Заполнение и согласование уравнений объема Имя:

Сопоставьте каждую проблему с уравнением, которое могло бы ее представить. Ответьте с пропущенным термином и буквой.

об)

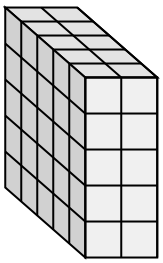

1)

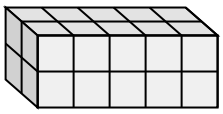

2)

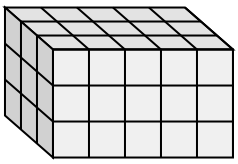

3)

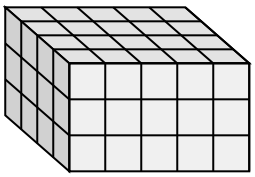

4)

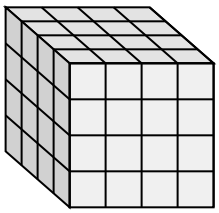

5)

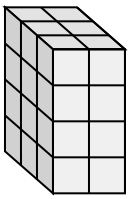

6)

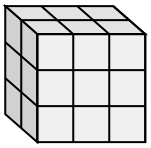

7)

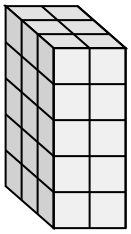

8)



9)

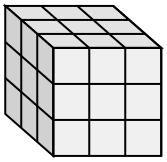

10)

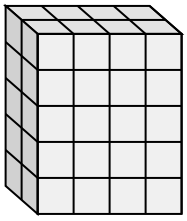

11)

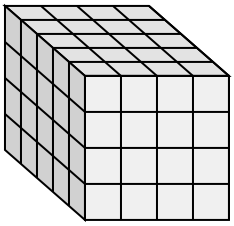

A. ___ × 2 × 5 = 30

B. ___ × 5 × 3 = 60

C. 3 × 3 × ___ = 27

D. 3 × 2 × ___ = 24

E. ___ × 4 × 5 = 100

F. 5 × ___ × 5 = 50

G. ___ × 4 × 4 = 64

H. 3 × 5 × ___ = 45

I. 2 × 5 × 2 = ___

J. ___ × 4 × 4 = 80

K. ___ × 3 × 3 = 18

L. 2 × 4 × ___ = 40

Ответы

об. F , 2

1. _____

2. _____

3. _____

4. _____

5. _____

6. _____

7. _____

8. _____

9. _____

10. _____

11. _____

1-10	91	82	73	64	55	45	36	27	18	9
11	0									

Заполнение и согласование уравнений объема Имя: Ключ к правильным ответам

Сопоставьте каждую проблему с уравнением, которое могло бы ее представить. Ответьте с пропущенным термином и буквой.

об)
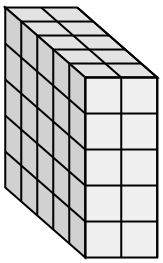

1)
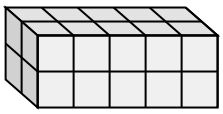

2)
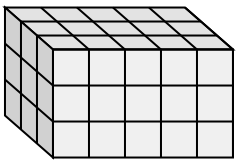

3)
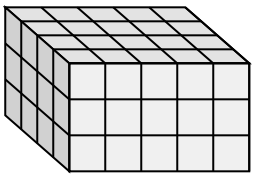

4)
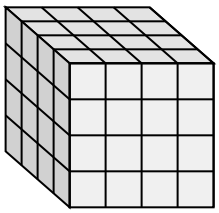

5)
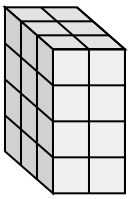

6)
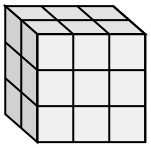

7)
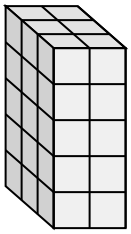

8)


9)
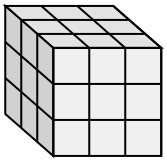

10)
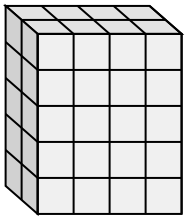

11)
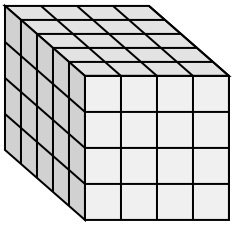

A. ___ × 2 × 5 = 30 **B.** ___ × 5 × 3 = 60 **C.** 3 × 3 × ___ = 27

D. 3 × 2 × ___ = 24 **E.** ___ × 4 × 5 = 100 **F.** 5 × ___ × 5 = 50

G. ___ × 4 × 4 = 64 **H.** 3 × 5 × ___ = 45 **I.** 2 × 5 × 2 = ___

J. ___ × 4 × 4 = 80 **K.** ___ × 3 × 3 = 18 **L.** 2 × 4 × ___ = 40

Ответы

об. F , 2
1. I , 20
2. H , 3
3. B , 4
4. G , 4
5. D , 4
6. K , 2
7. A , 3
8. E , 5
9. C , 3
10. L , 5
11. J , 5

1-10	91	82	73	64	55	45	36	27	18	9
11	0									