Заполнение и согласование уравнений объема Имя:

Сопоставьте каждую проблему с уравнением, которое могло бы ее представить. Ответьте с пропущенным термином и буквой.

об) 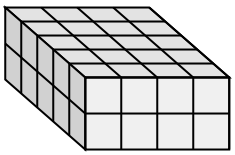

1) 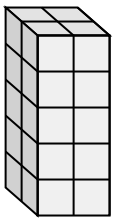

2) 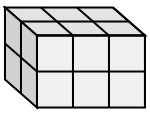

3) 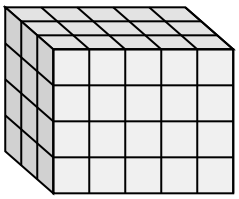

4) 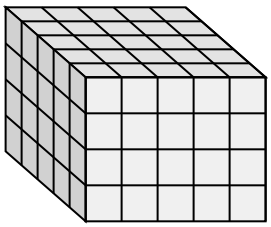

5) 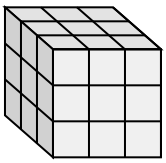

6) 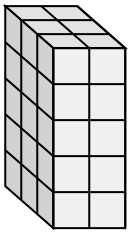

7) 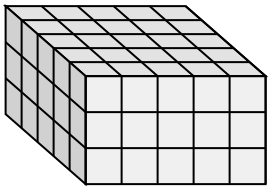

8) 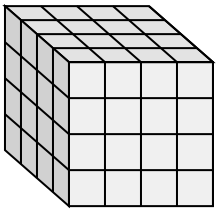

9) 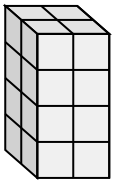

10) 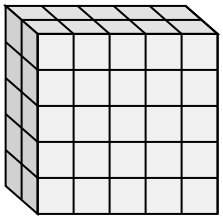

11) 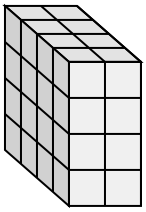

A. 5 × ___ × 4 = 100 **B.** 5 × 4 × ___ = 40 **C.** 5 × 5 × ___ = 75

D. ___ × 5 × 5 = 50 **E.** 3 × 5 × ___ = 60 **F.** 3 × 2 × 5 = ___

G. 4 × 2 × 4 = ___ **H.** 2 × 2 × ___ = 16 **I.** 2 × 3 × ___ = 12

J. 2 × 2 × 5 = ___ **K.** 3 × 3 × 3 = ___ **L.** 4 × ___ × 4 = 64

Ответы

об. **B , 2**

1. ___

2. ___

3. ___

4. ___

5. ___

6. ___

7. ___

8. ___

9. ___

10. ___

11. ___

1-10	91	82	73	64	55	45	36	27	18	9
11	0									

Заполнение и согласование уравнений объема Имя: **Ключ к правильным ответам**

Сопоставьте каждую проблему с уравнением, которое могло бы ее представить. Ответьте с пропущенным термином и буквой.

об) 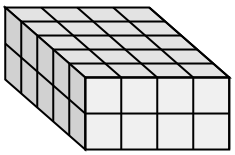

1) 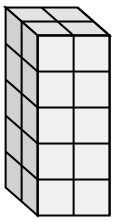

2) 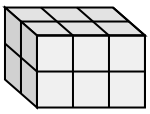

3) 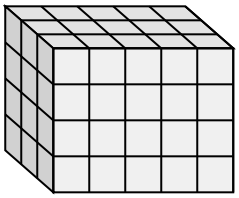

4) 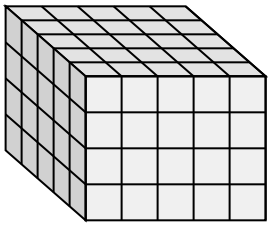

5) 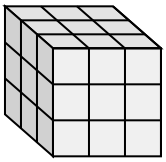

6) 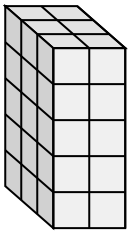

7) 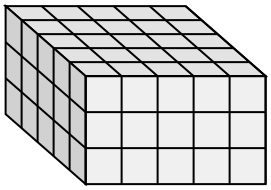

8) 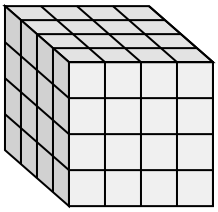

9) 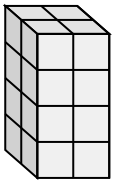

10) 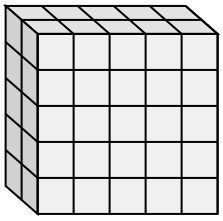

11) 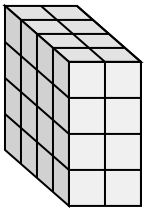

A. 5 × ___ × 4 = 100

B. 5 × 4 × ___ = 40

C. 5 × 5 × ___ = 75

D. ___ × 5 × 5 = 50

E. 3 × 5 × ___ = 60

F. 3 × 2 × 5 = ___

G. 4 × 2 × 4 = ___

H. 2 × 2 × ___ = 16

I. 2 × 3 × ___ = 12

J. 2 × 2 × 5 = ___

K. 3 × 3 × 3 = ___

L. 4 × ___ × 4 = 64

Ответы

об. **B , 2**

1. **J , 20**

2. **I , 2**

3. **E , 4**

4. **A , 5**

5. **K , 27**

6. **F , 30**

7. **C , 3**

8. **L , 4**

9. **H , 4**

10. **D , 2**

11. **G , 32**

1-10	91	82	73	64	55	45	36	27	18	9
11	0									