Заполнение и согласование уравнений объема Имя:

Сопоставьте каждую проблему с уравнением, которое могло бы ее представить. Ответьте с пропущенным термином и буквой.

об) 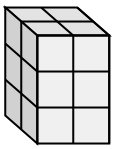

1) 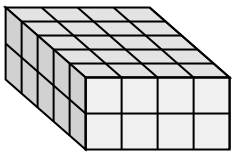

2) 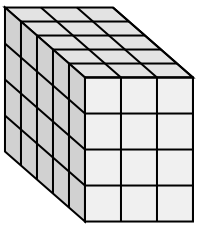

3) 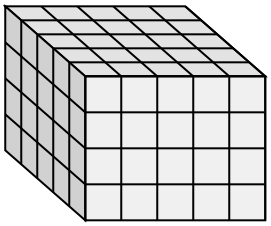

4) 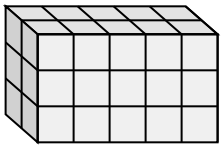

5) 

6) 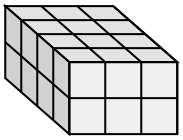

7) 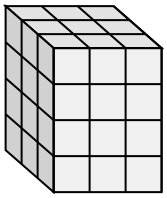

8) 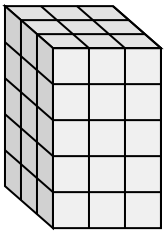

9) 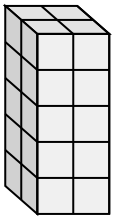

10) 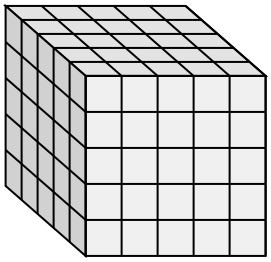

11) 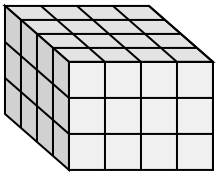

A. ___ × 2 × 5 = 20

B. 5 × ___ × 5 = 125

C. 2 × 2 × ___ = 12

D. 3 × 3 × ___ = 45

E. 3 × ___ × 4 = 36

F. 5 × 4 × ___ = 40

G. 4 × ___ × 2 = 24

H. ___ × 5 × 4 = 100

I. 2 × ___ × 3 = 30

J. ___ × 4 × 3 = 48

K. ___ × 3 × 4 = 60

L. 5 × 3 × 5 = ___

Ответы

об. C , 3

1. _____

2. _____

3. _____

4. _____

5. _____

6. _____

7. _____

8. _____

9. _____

10. _____

11. _____

1-10	91	82	73	64	55	45	36	27	18	9
11	0									

Заполнение и согласование уравнений объема Имя: Ключ к правильным ответам

Сопоставьте каждую проблему с уравнением, которое могло бы ее представить. Ответьте с пропущенным термином и буквой.

об)
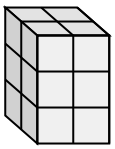

1)
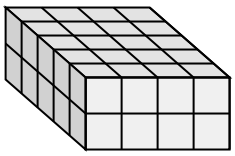

2)
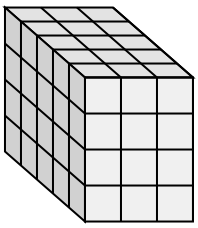

3)
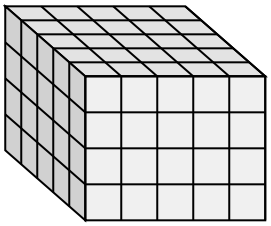

4)
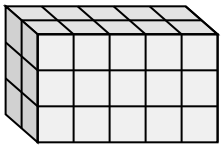

5)


6)
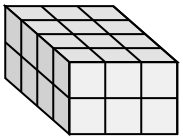

7)
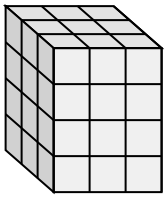

8)
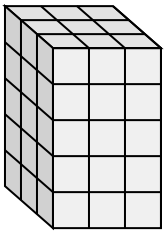

9)
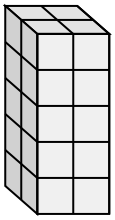

10)
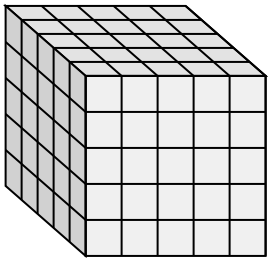

11)
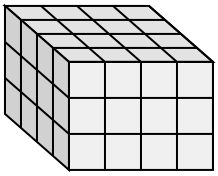

A. ___ × 2 × 5 = 20 **B.** 5 × ___ × 5 = 125 **C.** 2 × 2 × ___ = 12

D. 3 × 3 × ___ = 45 **E.** 3 × ___ × 4 = 36 **F.** 5 × 4 × ___ = 40

G. 4 × ___ × 2 = 24 **H.** ___ × 5 × 4 = 100 **I.** 2 × ___ × 3 = 30

J. ___ × 4 × 3 = 48 **K.** ___ × 3 × 4 = 60 **L.** 5 × 3 × 5 = ___

Ответы

об. C , 3
1. F , 2
2. K , 5
3. H , 5
4. I , 5
5. L , 75
6. G , 3
7. E , 3
8. D , 5
9. A , 2
10. B , 5
11. J , 4

1-10	91	82	73	64	55	45	36	27	18	9
11	0									