Заполнение и согласование уравнений объема Имя:

Сопоставьте каждую проблему с уравнением, которое могло бы ее представить. Ответьте с пропущенным термином и буквой.

об) 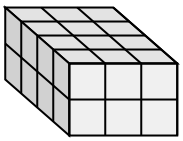

1) 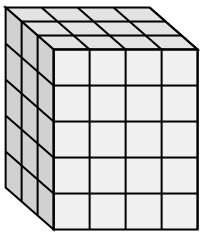

2) 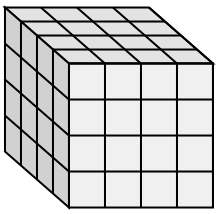

3) 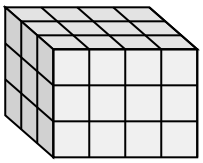

4) 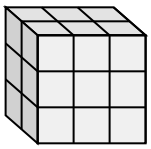

5) 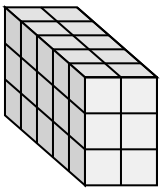

6) 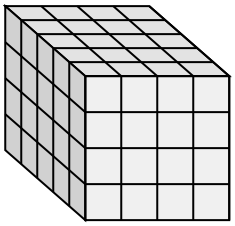

7) 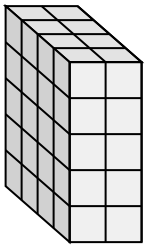

8) 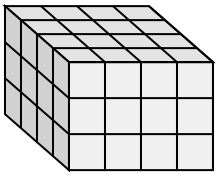

9) 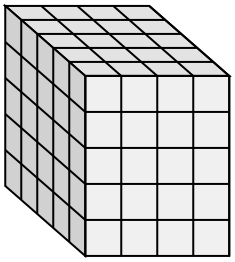

10) 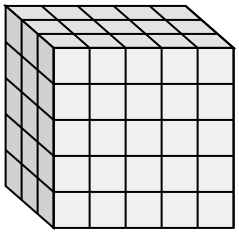

11) 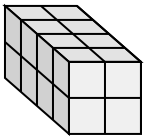

A. 4 × 4 × ___ = 48

B. 3 × 4 × 5 = ___

C. 4 × 2 × 2 = ___

D. 5 × 4 × ___ = 100

E. ___ × 2 × 5 = 40

F. 5 × 2 × ___ = 30

G. 3 × 4 × ___ = 36

H. 2 × 3 × ___ = 18

I. 5 × ___ × 4 = 80

J. ___ × 3 × 2 = 24

K. 4 × ___ × 4 = 64

L. ___ × 5 × 5 = 75

Ответы

об. J , 4

1. _____

2. _____

3. _____

4. _____

5. _____

6. _____

7. _____

8. _____

9. _____

10. _____

11. _____

1-10	91	82	73	64	55	45	36	27	18	9
11	0									

Заполнение и согласование уравнений объема Имя: Ключ к правильным ответам

Сопоставьте каждую проблему с уравнением, которое могло бы ее представить. Ответьте с пропущенным термином и буквой.

об) 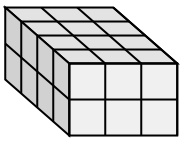

1) 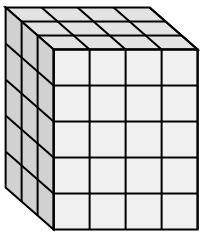

2) 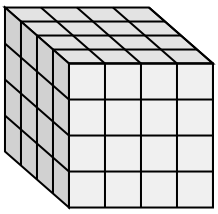

3) 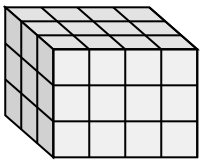

4) 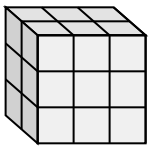

5) 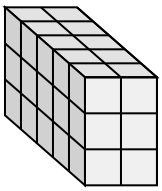

6) 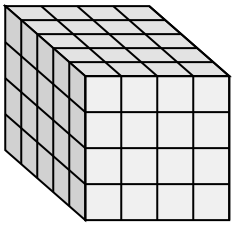

7) 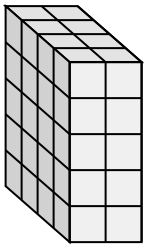

8) 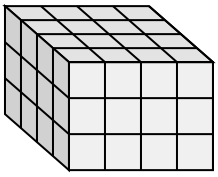

9) 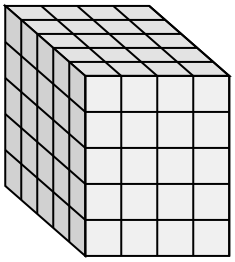

10) 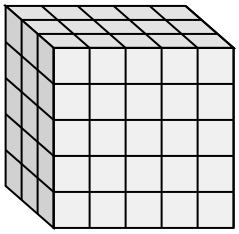

11) 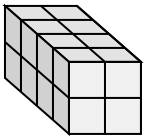

A. 4 × 4 × ___ = 48

B. 3 × 4 × 5 = ___

C. 4 × 2 × 2 = ___

D. 5 × 4 × ___ = 100

E. ___ × 2 × 5 = 40

F. 5 × 2 × ___ = 30

G. 3 × 4 × ___ = 36

H. 2 × 3 × ___ = 18

I. 5 × ___ × 4 = 80

J. ___ × 3 × 2 = 24

K. 4 × ___ × 4 = 64

L. ___ × 5 × 5 = 75

Ответы

об. J , 4

1. B , 60

2. K , 4

3. G , 3

4. H , 3

5. F , 3

6. I , 4

7. E , 4

8. A , 3

9. D , 5

10. L , 3

11. C , 16

1-10	91	82	73	64	55	45	36	27	18	9
11	0									