Заполнение и согласование уравнений объема Имя:

**Сопоставьте каждую проблему с уравнением, которое могло бы ее представить. Ответьте с пропущенным термином и буквой.**

**об)** 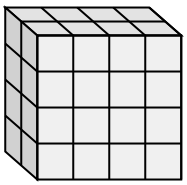

**1)** 

**2)** 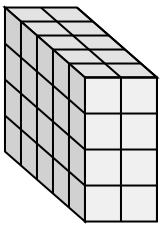

**3)** 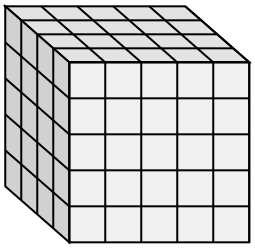

**4)** 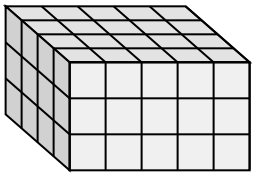

**5)** 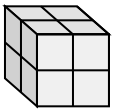

**6)** 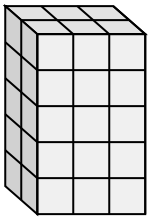

**7)** 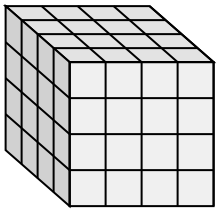

**8)** 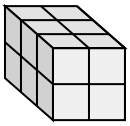

**9)** 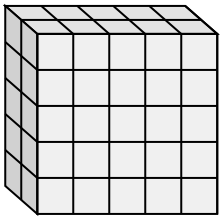

**10)** 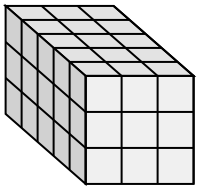

**11)** 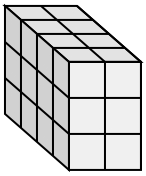

**A.** 4 × 5 × 3 = ___

**B.** 4 × ___ × 3 = 24

**C.** 2 × 3 × 5 = ___

**D.** ___ × 2 × 2 = 12

**E.** ___ × 5 × 5 = 50

**F.** ___ × 3 × 3 = 45

**G.** 5 × ___ × 4 = 40

**H.** 5 × 3 × 5 = ___

**I.** 4 × ___ × 4 = 64

**J.** 2 × ___ × 4 = 32

**K.** 4 × ___ × 5 = 100

**L.** 2 × ___ × 2 = 8

## Ответы

об. J , 4

1. ___

2. ___

3. ___

4. ___

5. ___

6. ___

7. ___

8. ___

9. ___

10. ___

11. ___



| | | | | | | | | | | |
|---|---|---|---|---|---|---|---|---|---|---|
| 1-10 | 91 | 82 | 73 | 64 | 55 | 45 | 36 | 27 | 18 | 9 |
| 11 | 0 | | | | | | | | | |

**Сопоставьте каждую проблему с уравнением, которое могло бы ее представить. Ответьте с пропущенным термином и буквой.**

об)
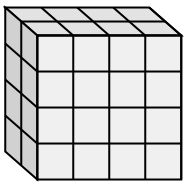

1)


2)
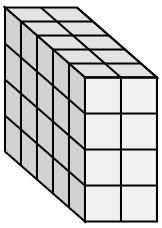

3)
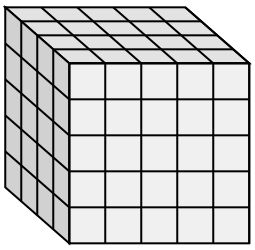

4)
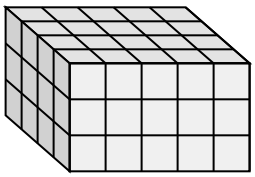

5)
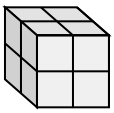

6)
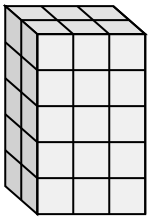

7)
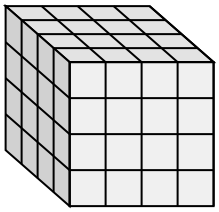

8)
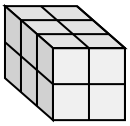

9)
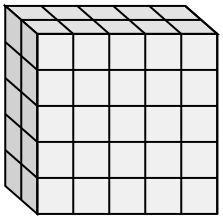

10)
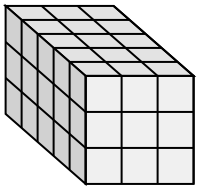

11)
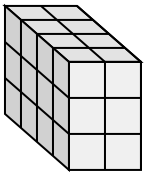

**A.** 4 × 5 × 3 = ___ **B.** 4 × ___ × 3 = 24 **C.** 2 × 3 × 5 = ___

**D.** ___ × 2 × 2 = 12 **E.** ___ × 5 × 5 = 50 **F.** ___ × 3 × 3 = 45

**G.** 5 × ___ × 4 = 40 **H.** 5 × 3 × 5 = ___ **I.** 4 × ___ × 4 = 64

**J.** 2 × ___ × 4 = 32 **K.** 4 × ___ × 5 = 100 **L.** 2 × ___ × 2 = 8

## Ответы

об. J , 4
1. H , 75
2. G , 2
3. K , 5
4. A , 60
5. L , 2
6. C , 30
7. I , 4
8. D , 3
9. E , 2
10. F , 5
11. B , 2



| | | | | | | | | | | |
|---|---|---|---|---|---|---|---|---|---|---|
| 1-10 | 91 | 82 | 73 | 64 | 55 | 45 | 36 | 27 | 18 | 9 |
| 11 | 0 | | | | | | | | | |