Заполнение и согласование уравнений объема Имя:

Сопоставьте каждую проблему с уравнением, которое могло бы ее представить. Ответьте с пропущенным термином и буквой.

об) 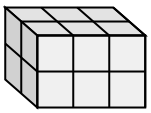

1) 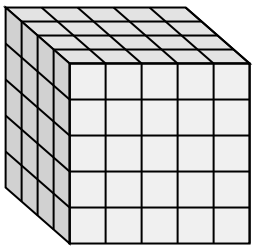

2) 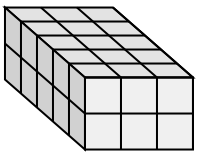

3) 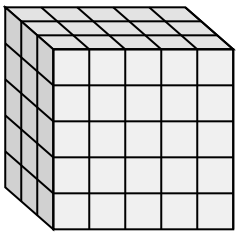

4) 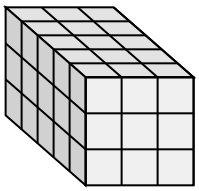

5) 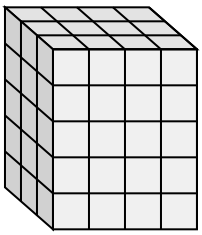

6) 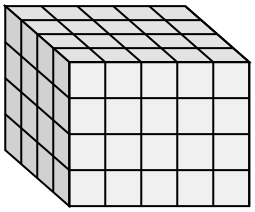

7) 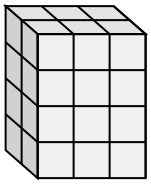

8) 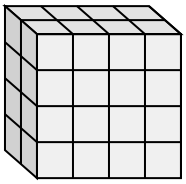

9) 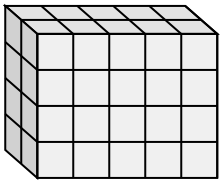

10) 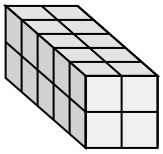

11) 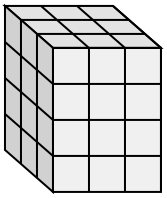

A. 3 × ___ × 5 = 60

B. ___ × 3 × 2 = 12

C. 2 × ___ × 4 = 40

D. 2 × 3 × ___ = 24

E. 4 × 5 × ___ = 80

F. ___ × 3 × 3 = 45

G. 5 × 2 × ___ = 20

H. 3 × 5 × 5 = ___

I. 4 × 5 × ___ = 100

J. ___ × 3 × 4 = 36

K. 5 × 3 × 2 = ___

L. ___ × 4 × 4 = 32

Ответы

об. **B , 2**

1. _____

2. _____

3. _____

4. _____

5. _____

6. _____

7. _____

8. _____

9. _____

10. _____

11. _____

1-10	91	82	73	64	55	45	36	27	18	9
11	0									

Заполнение и согласование уравнений объема Имя: Ключ к правильным ответам

Сопоставьте каждую проблему с уравнением, которое могло бы ее представить. Ответьте с пропущенным термином и буквой.

об) 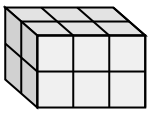

1) 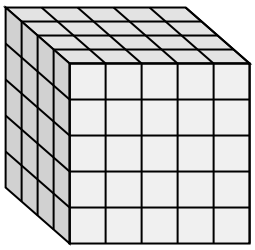

2) 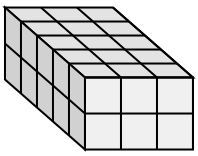

3) 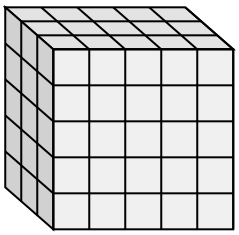

4) 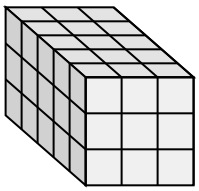

5) 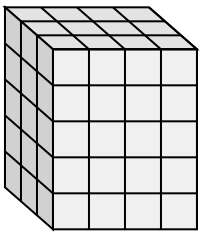

6) 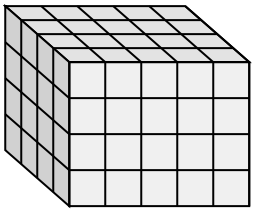

7) 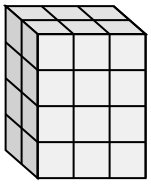

8) 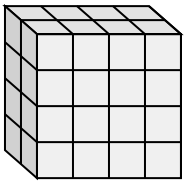

9) 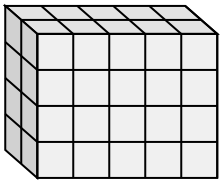

10) 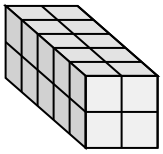

11) 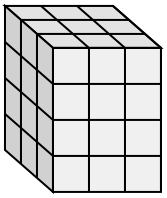

A. 3 × ___ × 5 = 60 **B.** ___ × 3 × 2 = 12 **C.** 2 × ___ × 4 = 40

D. 2 × 3 × ___ = 24 **E.** 4 × 5 × ___ = 80 **F.** ___ × 3 × 3 = 45

G. 5 × 2 × ___ = 20 **H.** 3 × 5 × 5 = ___ **I.** 4 × 5 × ___ = 100

J. ___ × 3 × 4 = 36 **K.** 5 × 3 × 2 = ___ **L.** ___ × 4 × 4 = 32

Ответы

об. B , 2

1. I , 5

2. K , 30

3. H , 75

4. F , 5

5. A , 4

6. E , 4

7. D , 4

8. L , 2

9. C , 5

10. G , 2

11. J , 3

1-10	91	82	73	64	55	45	36	27	18	9
11	0									