Заполнение и согласование уравнений объема Имя:

Сопоставьте каждую проблему с уравнением, которое могло бы ее представить. Ответьте с пропущенным термином и буквой.

об)

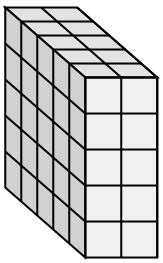

1)

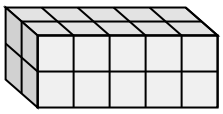

2)

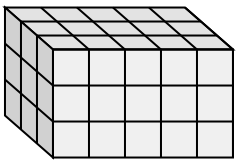

3)

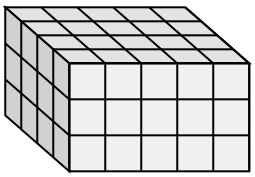

4)

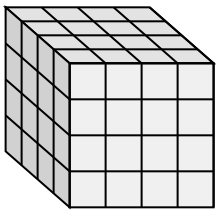

5)

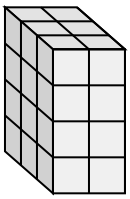

6)

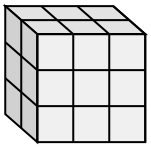

7)

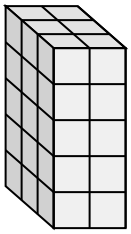

8)



9)

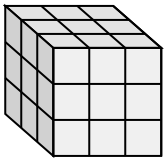

10)

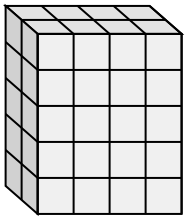

11)

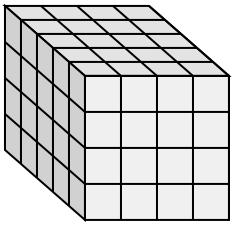

A. ___ × 2 × 5 = 30

B. ___ × 5 × 3 = 60

C. 3 × 3 × ___ = 27

D. 3 × 2 × ___ = 24

E. ___ × 4 × 5 = 100

F. 5 × ___ × 5 = 50

G. ___ × 4 × 4 = 64

H. 3 × 5 × ___ = 45

I. 2 × 5 × 2 = ___

J. ___ × 4 × 4 = 80

K. ___ × 3 × 3 = 18

L. 2 × 4 × ___ = 40

Ответы

об. F , 2

1. _____

2. _____

3. _____

4. _____

5. _____

6. _____

7. _____

8. _____

9. _____

10. _____

11. _____

1-10	91	82	73	64	55	45	36	27	18	9
11	0									

Заполнение и согласование уравнений объема Имя: Ключ к правильным ответам

Сопоставьте каждую проблему с уравнением, которое могло бы ее представить. Ответьте с пропущенным термином и буквой.

об)
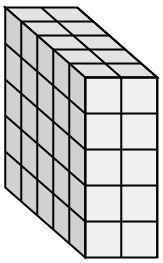

1)
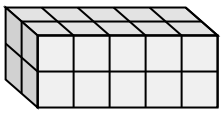

2)
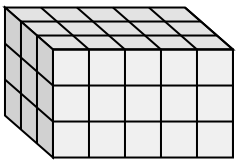

3)
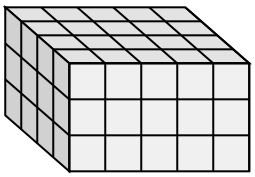

4)
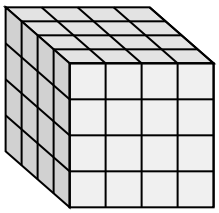

5)
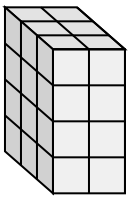

6)
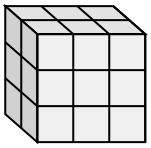

7)
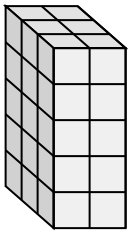

8)


9)
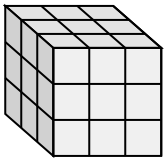

10)
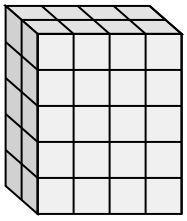

11)
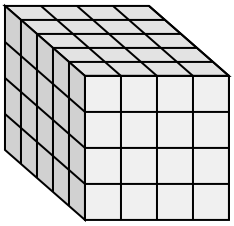

A. ___ × 2 × 5 = 30 **B.** ___ × 5 × 3 = 60 **C.** 3 × 3 × ___ = 27

D. 3 × 2 × ___ = 24 **E.** ___ × 4 × 5 = 100 **F.** 5 × ___ × 5 = 50

G. ___ × 4 × 4 = 64 **H.** 3 × 5 × ___ = 45 **I.** 2 × 5 × 2 = ___

J. ___ × 4 × 4 = 80 **K.** ___ × 3 × 3 = 18 **L.** 2 × 4 × ___ = 40

Ответы

об. F , 2
1. I , 20
2. H , 3
3. B , 4
4. G , 4
5. D , 4
6. K , 2
7. A , 3
8. E , 5
9. C , 3
10. L , 5
11. J , 5

1-10	91	82	73	64	55	45	36	27	18	9
11	0									

Заполнение и согласование уравнений объема Имя:

Сопоставьте каждую проблему с уравнением, которое могло бы ее представить. Ответьте с пропущенным термином и буквой.

об) 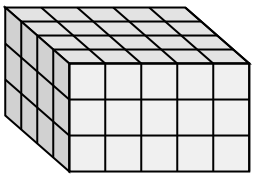

1) 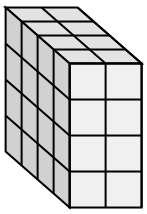

2) 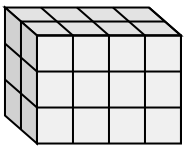

3) 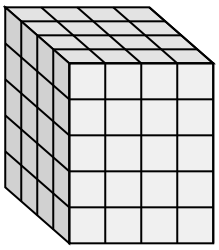

4) 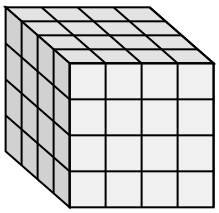

5) 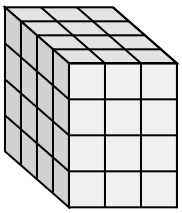

6) 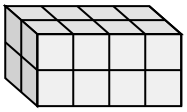

7) 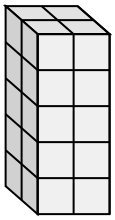

8) 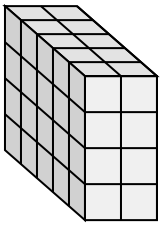

9) 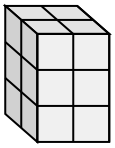

10) 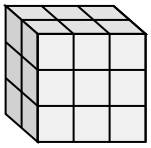

11) 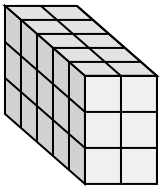

A. 2 × 2 × 3 = ___

B. ___ × 2 × 4 = 40

C. 2 × 3 × ___ = 18

D. 2 × 4 × ___ = 24

E. 4 × 5 × 3 = ___

F. 2 × 2 × 5 = ___

G. 4 × ___ × 4 = 64

H. ___ × 4 × 2 = 16

I. 4 × 4 × ___ = 80

J. ___ × 3 × 4 = 48

K. 4 × 2 × 4 = ___

L. 5 × ___ × 3 = 30

Ответы

об. E , 60

1. ___

2. ___

3. ___

4. ___

5. ___

6. ___

7. ___

8. ___

9. ___

10. ___

11. ___

1-10	91	82	73	64	55	45	36	27	18	9
11	0									

Заполнение и согласование уравнений объема Имя: Ключ к правильным ответам

Сопоставьте каждую проблему с уравнением, которое могло бы ее представить. Ответьте с пропущенным термином и буквой.

об) 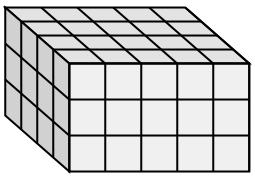

1) 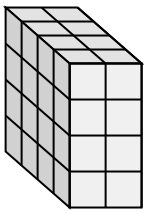

2) 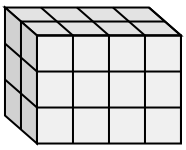

3) 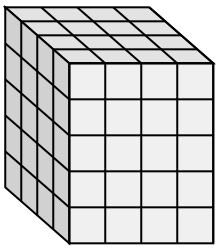

4) 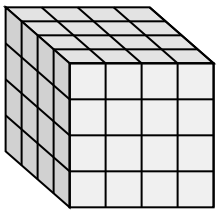

5) 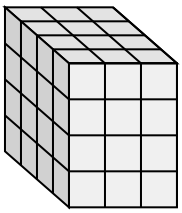

6) 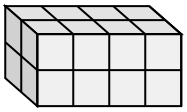

7) 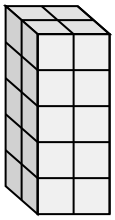

8) 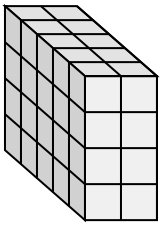

9) 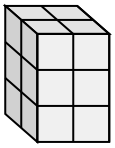

10) 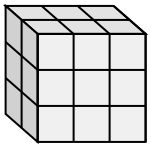

11) 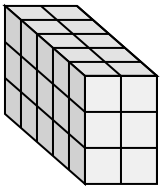

A. 2 × 2 × 3 = ___

B. ___ × 2 × 4 = 40

C. 2 × 3 × ___ = 18

D. 2 × 4 × ___ = 24

E. 4 × 5 × 3 = ___

F. 2 × 2 × 5 = ___

G. 4 × ___ × 4 = 64

H. ___ × 4 × 2 = 16

I. 4 × 4 × ___ = 80

J. ___ × 3 × 4 = 48

K. 4 × 2 × 4 = ___

L. 5 × ___ × 3 = 30

Ответы

об. E , 60

1. K , 32

2. D , 3

3. I , 5

4. G , 4

5. J , 4

6. H , 2

7. F , 20

8. B , 5

9. A , 12

10. C , 3

11. L , 2

1-10	91	82	73	64	55	45	36	27	18	9
11	0									

Заполнение и согласование уравнений объема Имя:

Сопоставьте каждую проблему с уравнением, которое могло бы ее представить. Ответьте с пропущенным термином и буквой.

об) 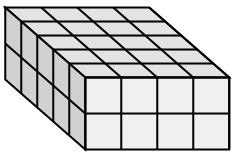

1) 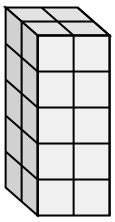

2) 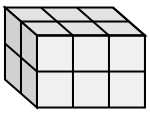

3) 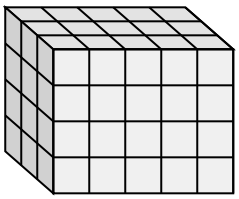

4) 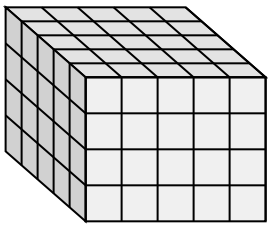

5) 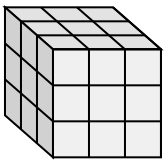

6) 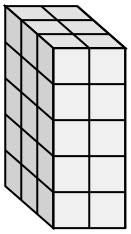

7) 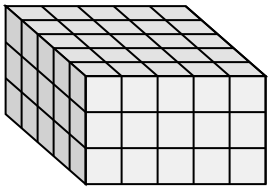

8) 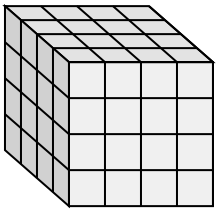

9) 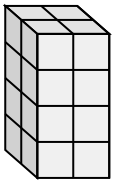

10) 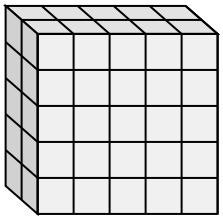

11) 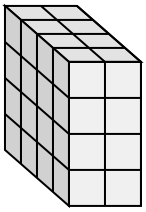

A. 5 × ___ × 4 = 100 **B.** 5 × 4 × ___ = 40 **C.** 5 × 5 × ___ = 75

D. ___ × 5 × 5 = 50 **E.** 3 × 5 × ___ = 60 **F.** 3 × 2 × 5 = ___

G. 4 × 2 × 4 = ___ **H.** 2 × 2 × ___ = 16 **I.** 2 × 3 × ___ = 12

J. 2 × 2 × 5 = ___ **K.** 3 × 3 × 3 = ___ **L.** 4 × ___ × 4 = 64

Ответы

об. **B , 2**

1. ___

2. ___

3. ___

4. ___

5. ___

6. ___

7. ___

8. ___

9. ___

10. ___

11. ___

1-10	91	82	73	64	55	45	36	27	18	9
11	0									

Заполнение и согласование уравнений объема Имя: **Ключ к правильным ответам**

Сопоставьте каждую проблему с уравнением, которое могло бы ее представить. Ответьте с пропущенным термином и буквой.

об) 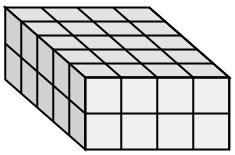

1) 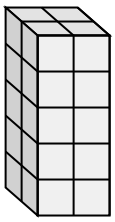

2) 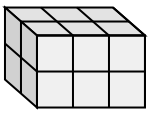

3) 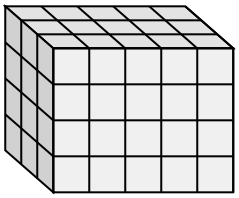

4) 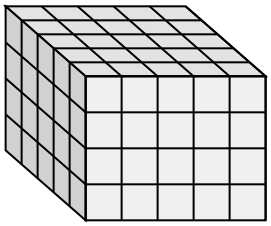

5) 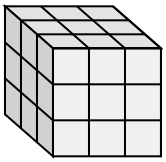

6) 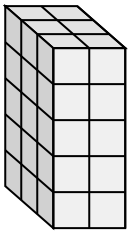

7) 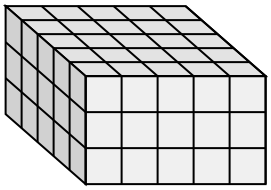

8) 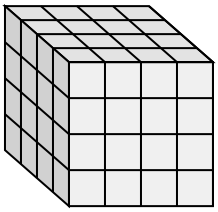

9) 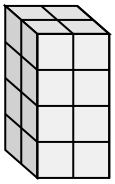

10) 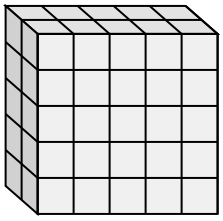

11) 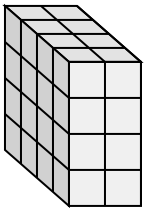

A. 5 × ___ × 4 = 100

B. 5 × 4 × ___ = 40

C. 5 × 5 × ___ = 75

D. ___ × 5 × 5 = 50

E. 3 × 5 × ___ = 60

F. 3 × 2 × 5 = ___

G. 4 × 2 × 4 = ___

H. 2 × 2 × ___ = 16

I. 2 × 3 × ___ = 12

J. 2 × 2 × 5 = ___

K. 3 × 3 × 3 = ___

L. 4 × ___ × 4 = 64

Ответы

об. **B , 2**

1. **J , 20**

2. **I , 2**

3. **E , 4**

4. **A , 5**

5. **K , 27**

6. **F , 30**

7. **C , 3**

8. **L , 4**

9. **H , 4**

10. **D , 2**

11. **G , 32**

1-10	91	82	73	64	55	45	36	27	18	9
11	0									

Заполнение и согласование уравнений объема Имя:

Сопоставьте каждую проблему с уравнением, которое могло бы ее представить. Ответьте с пропущенным термином и буквой.

об) 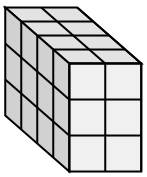

1) 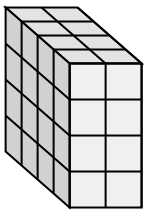

2) 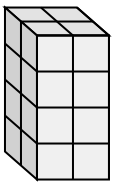

3) 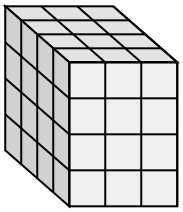

4) 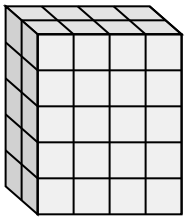

5) 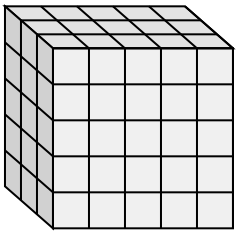

6) 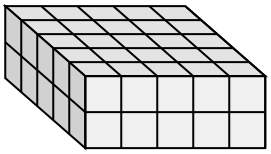

7) 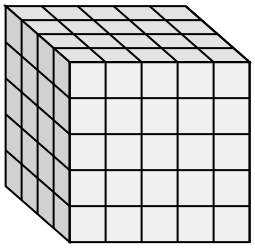

8) 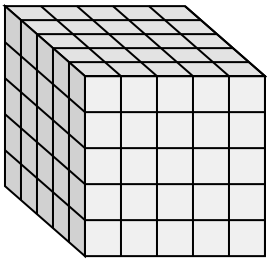

9) 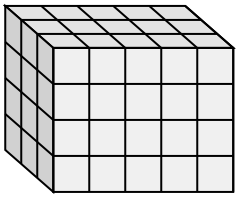

10) 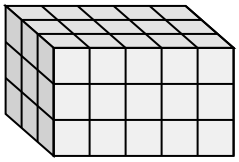

11) 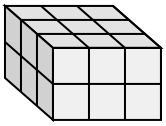

A. 3 × ___ × 4 = 60

B. ___ × 4 × 5 = 40

C. 3 × ___ × 2 = 18

D. ___ × 2 × 3 = 24

E. ___ × 2 × 4 = 16

F. 3 × ___ × 3 = 45

G. 4 × ___ × 5 = 100

H. 5 × 5 × 2 = ___

I. 4 × 2 × ___ = 32

J. ___ × 5 × 5 = 75

K. 4 × 3 × ___ = 48

L. 5 × 5 × ___ = 125

Ответы

об. D , 4

1. _____

2. _____

3. _____

4. _____

5. _____

6. _____

7. _____

8. _____

9. _____

10. _____

11. _____

1-10	91	82	73	64	55	45	36	27	18	9
11	0									

Сопоставьте каждую проблему с уравнением, которое могло бы ее представить. Ответьте с пропущенным термином и буквой.

об)
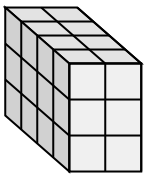

1)
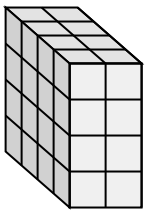

2)
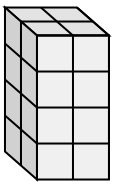

3)
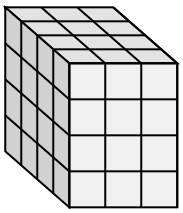

4)
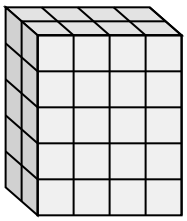

5)
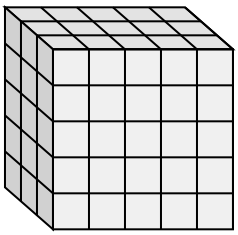

6)
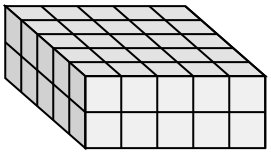

7)
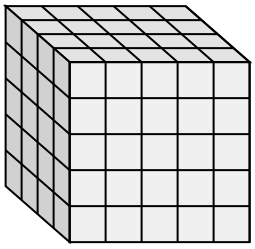

8)
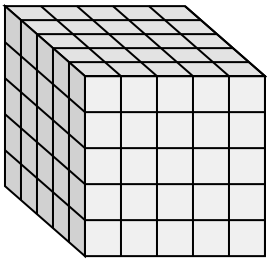

9)
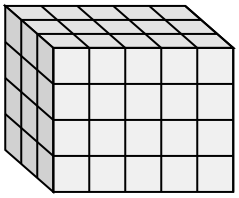

10)
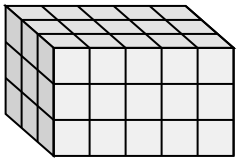

11)
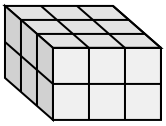

A. 3 × ___ × 4 = 60

B. ___ × 4 × 5 = 40

C. 3 × ___ × 2 = 18

D. ___ × 2 × 3 = 24

E. ___ × 2 × 4 = 16

F. 3 × ___ × 3 = 45

G. 4 × ___ × 5 = 100

H. 5 × 5 × 2 = ___

I. 4 × 2 × ___ = 32

J. ___ × 5 × 5 = 75

K. 4 × 3 × ___ = 48

L. 5 × 5 × ___ = 125

Ответы

об. D , 4

1. I , 4

2. E , 2

3. K , 4

4. B , 2

5. J , 3

6. H , 50

7. G , 5

8. L , 5

9. A , 5

10. F , 5

11. C , 3

1-10	91	82	73	64	55	45	36	27	18	9
11	0									

Заполнение и согласование уравнений объема Имя:

Сопоставьте каждую проблему с уравнением, которое могло бы ее представить. Ответьте с пропущенным термином и буквой.

об) 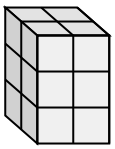

1) 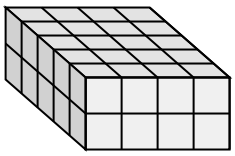

2) 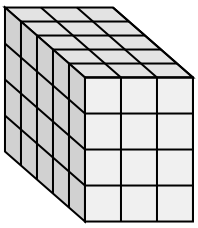

3) 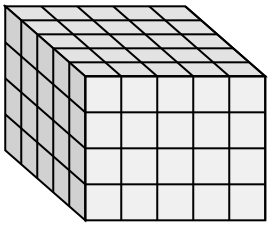

4) 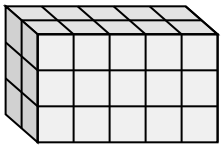

5) 

6) 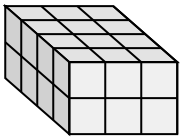

7) 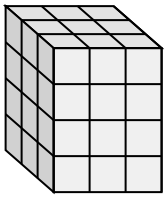

8) 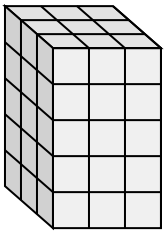

9) 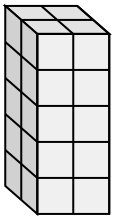

10) 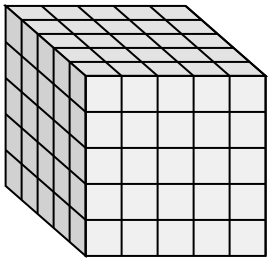

11) 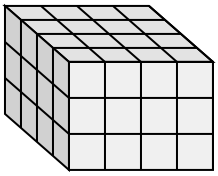

A. ___ × 2 × 5 = 20

B. 5 × ___ × 5 = 125

C. 2 × 2 × ___ = 12

D. 3 × 3 × ___ = 45

E. 3 × ___ × 4 = 36

F. 5 × 4 × ___ = 40

G. 4 × ___ × 2 = 24

H. ___ × 5 × 4 = 100

I. 2 × ___ × 3 = 30

J. ___ × 4 × 3 = 48

K. ___ × 3 × 4 = 60

L. 5 × 3 × 5 = ___

Ответы

об. C , 3

1. _____

2. _____

3. _____

4. _____

5. _____

6. _____

7. _____

8. _____

9. _____

10. _____

11. _____

1-10	91	82	73	64	55	45	36	27	18	9
11	0									

Заполнение и согласование уравнений объема Имя: Ключ к правильным ответам

Сопоставьте каждую проблему с уравнением, которое могло бы ее представить. Ответьте с пропущенным термином и буквой.

об)
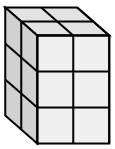

1)
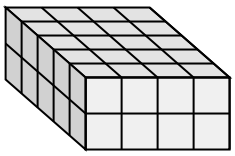

2)
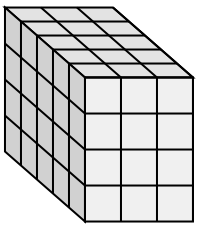

3)
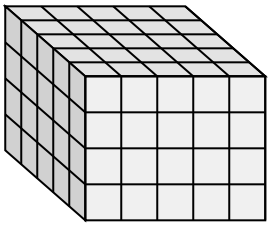

4)
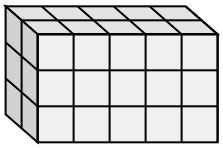

5)


6)
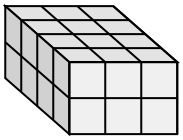

7)
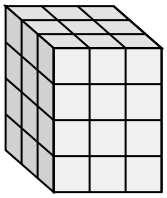

8)
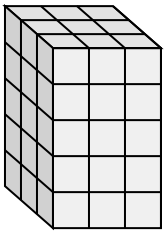

9)
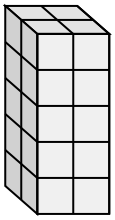

10)
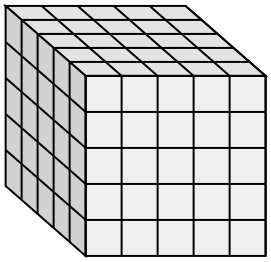

11)
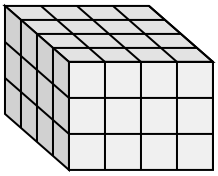

A. ___ × 2 × 5 = 20 **B.** 5 × ___ × 5 = 125 **C.** 2 × 2 × ___ = 12

D. 3 × 3 × ___ = 45 **E.** 3 × ___ × 4 = 36 **F.** 5 × 4 × ___ = 40

G. 4 × ___ × 2 = 24 **H.** ___ × 5 × 4 = 100 **I.** 2 × ___ × 3 = 30

J. ___ × 4 × 3 = 48 **K.** ___ × 3 × 4 = 60 **L.** 5 × 3 × 5 = ___

Ответы

об. C , 3
1. F , 2
2. K , 5
3. H , 5
4. I , 5
5. L , 75
6. G , 3
7. E , 3
8. D , 5
9. A , 2
10. B , 5
11. J , 4

1-10	91	82	73	64	55	45	36	27	18	9
11	0									

Заполнение и согласование уравнений объема Имя:

Сопоставьте каждую проблему с уравнением, которое могло бы ее представить. Ответьте с пропущенным термином и буквой.

об) 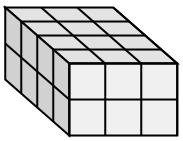

1) 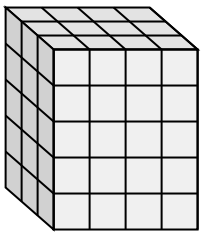

2) 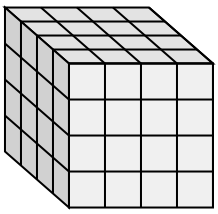

3) 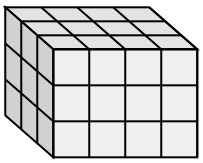

4) 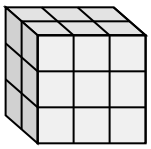

5) 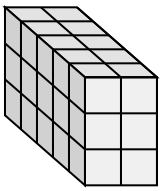

6) 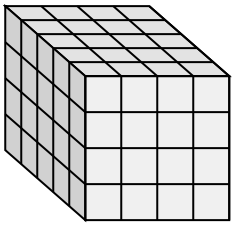

7) 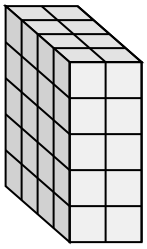

8) 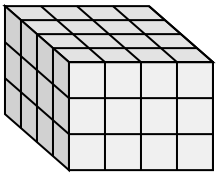

9) 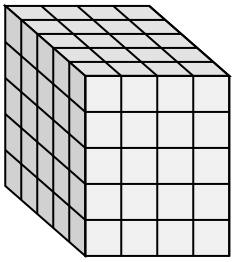

10) 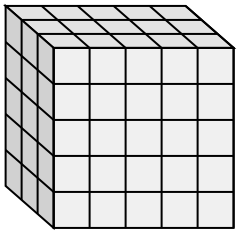

11) 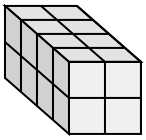

A. 4 × 4 × ___ = 48

B. 3 × 4 × 5 = ___

C. 4 × 2 × 2 = ___

D. 5 × 4 × ___ = 100

E. ___ × 2 × 5 = 40

F. 5 × 2 × ___ = 30

G. 3 × 4 × ___ = 36

H. 2 × 3 × ___ = 18

I. 5 × ___ × 4 = 80

J. ___ × 3 × 2 = 24

K. 4 × ___ × 4 = 64

L. ___ × 5 × 5 = 75

Ответы

об. J , 4

1. _____

2. _____

3. _____

4. _____

5. _____

6. _____

7. _____

8. _____

9. _____

10. _____

11. _____

1-10	91	82	73	64	55	45	36	27	18	9
11	0									

Заполнение и согласование уравнений объема Имя: Ключ к правильным ответам

Сопоставьте каждую проблему с уравнением, которое могло бы ее представить. Ответьте с пропущенным термином и буквой.

об) 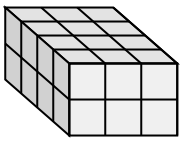

1) 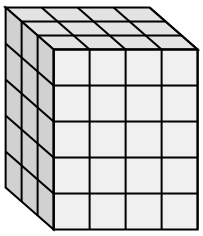

2) 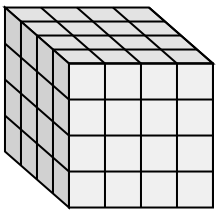

3) 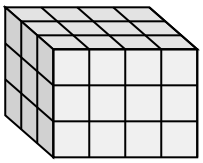

4) 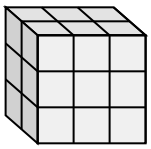

5) 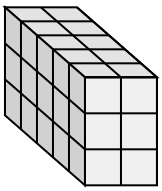

6) 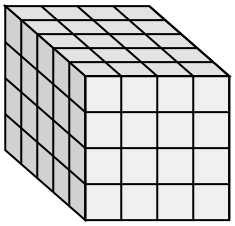

7) 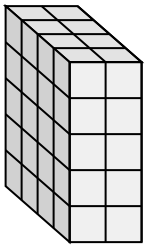

8) 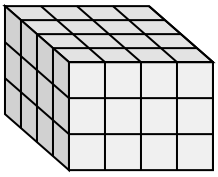

9) 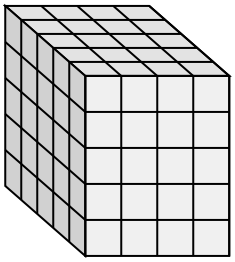

10) 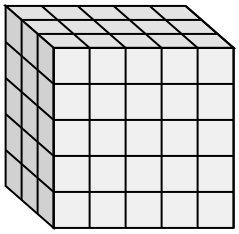

11) 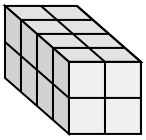

A. 4 × 4 × ___ = 48

B. 3 × 4 × 5 = ___

C. 4 × 2 × 2 = ___

D. 5 × 4 × ___ = 100

E. ___ × 2 × 5 = 40

F. 5 × 2 × ___ = 30

G. 3 × 4 × ___ = 36

H. 2 × 3 × ___ = 18

I. 5 × ___ × 4 = 80

J. ___ × 3 × 2 = 24

K. 4 × ___ × 4 = 64

L. ___ × 5 × 5 = 75

Ответы

об. J , 4

1. B , 60

2. K , 4

3. G , 3

4. H , 3

5. F , 3

6. I , 4

7. E , 4

8. A , 3

9. D , 5

10. L , 3

11. C , 16

1-10	91	82	73	64	55	45	36	27	18	9
11	0									

Заполнение и согласование уравнений объема Имя:

Сопоставьте каждую проблему с уравнением, которое могло бы ее представить. Ответьте с пропущенным термином и буквой.

об) 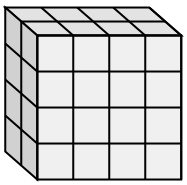

1) 

2) 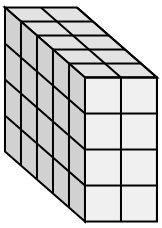

3) 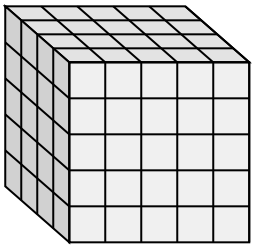

4) 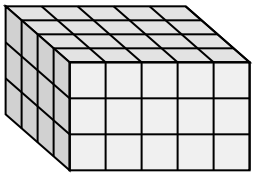

5) 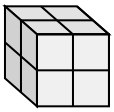

6) 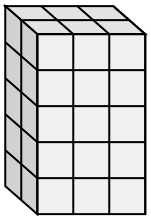

7) 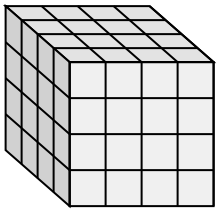

8) 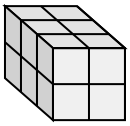

9) 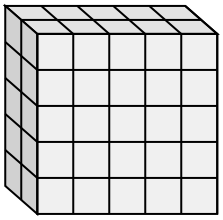

10) 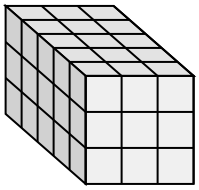

11) 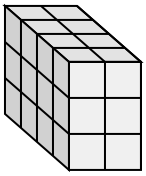

A. 4 × 5 × 3 = ___

B. 4 × ___ × 3 = 24

C. 2 × 3 × 5 = ___

D. ___ × 2 × 2 = 12

E. ___ × 5 × 5 = 50

F. ___ × 3 × 3 = 45

G. 5 × ___ × 4 = 40

H. 5 × 3 × 5 = ___

I. 4 × ___ × 4 = 64

J. 2 × ___ × 4 = 32

K. 4 × ___ × 5 = 100

L. 2 × ___ × 2 = 8

Ответы

об. J , 4

1. ___

2. ___

3. ___

4. ___

5. ___

6. ___

7. ___

8. ___

9. ___

10. ___

11. ___

1-10	91	82	73	64	55	45	36	27	18	9
11	0									

Сопоставьте каждую проблему с уравнением, которое могло бы ее представить. Ответьте с пропущенным термином и буквой.

об)
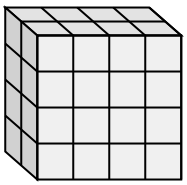

1)


2)
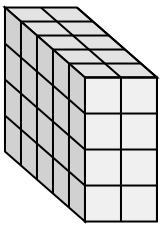

3)
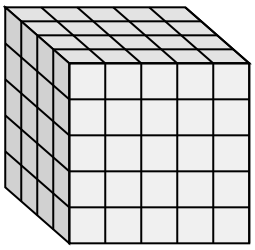

4)
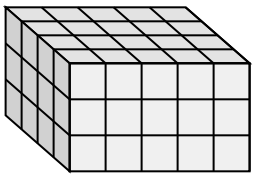

5)
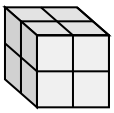

6)
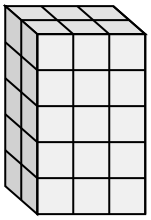

7)
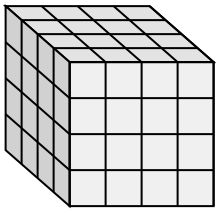

8)
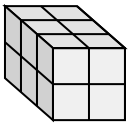

9)
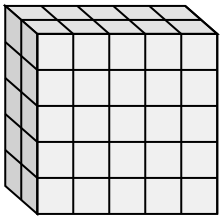

10)
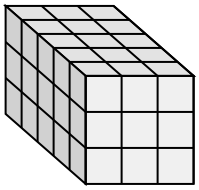

11)
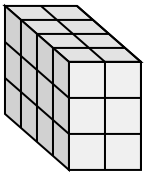

A. 4 × 5 × 3 = ___ **B.** 4 × ___ × 3 = 24 **C.** 2 × 3 × 5 = ___

D. ___ × 2 × 2 = 12 **E.** ___ × 5 × 5 = 50 **F.** ___ × 3 × 3 = 45

G. 5 × ___ × 4 = 40 **H.** 5 × 3 × 5 = ___ **I.** 4 × ___ × 4 = 64

J. 2 × ___ × 4 = 32 **K.** 4 × ___ × 5 = 100 **L.** 2 × ___ × 2 = 8

Ответы

об. J , 4
1. H , 75
2. G , 2
3. K , 5
4. A , 60
5. L , 2
6. C , 30
7. I , 4
8. D , 3
9. E , 2
10. F , 5
11. B , 2

1-10	91	82	73	64	55	45	36	27	18	9
11	0									

Заполнение и согласование уравнений объема Имя:

Сопоставьте каждую проблему с уравнением, которое могло бы ее представить. Ответьте с пропущенным термином и буквой.

об) 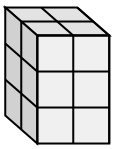

1) 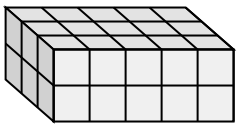

2) 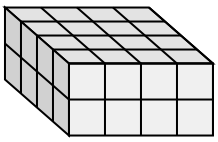

3) 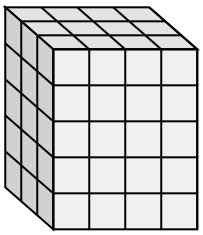

4) 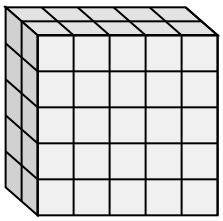

5) 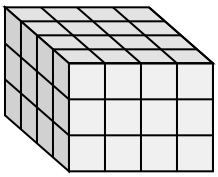

6) 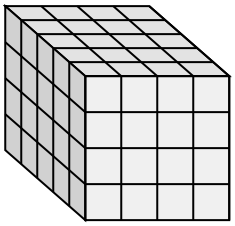

7) 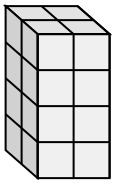

8) 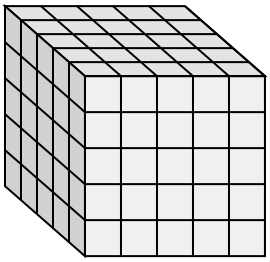

9) 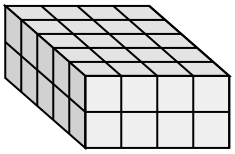

10) 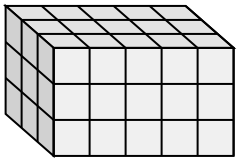

11) 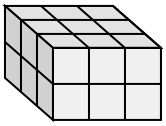

A. ___ × 4 × 3 = 48

B. ___ × 5 × 5 = 125

C. ___ × 5 × 3 = 45

D. 2 × 2 × 3 = ___

E. 3 × ___ × 2 = 18

F. 3 × ___ × 2 = 30

G. 2 × ___ × 4 = 16

H. 2 × 5 × ___ = 50

I. 4 × 4 × ___ = 32

J. ___ × 4 × 2 = 40

K. 3 × 4 × ___ = 60

L. ___ × 4 × 4 = 80

Ответы

об. D , 12

1. _____

2. _____

3. _____

4. _____

5. _____

6. _____

7. _____

8. _____

9. _____

10. _____

11. _____

1-10	91	82	73	64	55	45	36	27	18	9
11	0									

Заполнение и согласование уравнений объема Имя: **Ключ к правильным ответам**

Сопоставьте каждую проблему с уравнением, которое могло бы ее представить. Ответьте с пропущенным термином и буквой.

об) 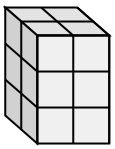

1) 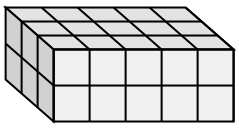

2) 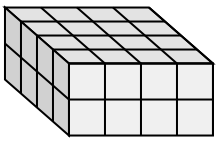

3) 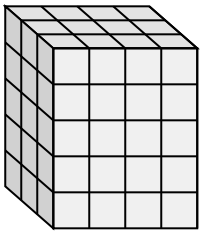

4) 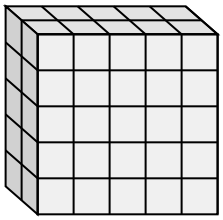

5) 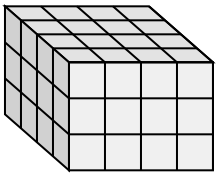

6) 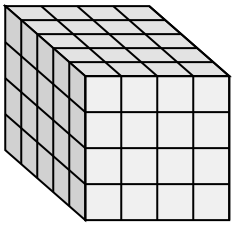

7) 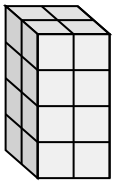

8) 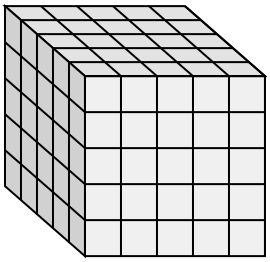

9) 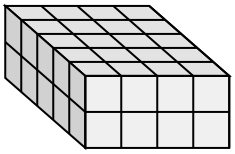

10) 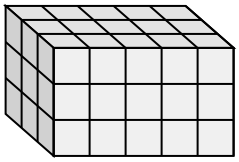

11) 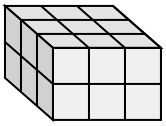

A. ___ × 4 × 3 = 48

B. ___ × 5 × 5 = 125

C. ___ × 5 × 3 = 45

D. 2 × 2 × 3 = ___

E. 3 × ___ × 2 = 18

F. 3 × ___ × 2 = 30

G. 2 × ___ × 4 = 16

H. 2 × 5 × ___ = 50

I. 4 × 4 × ___ = 32

J. ___ × 4 × 2 = 40

K. 3 × 4 × ___ = 60

L. ___ × 4 × 4 = 80

Ответы

об.	D , 12
1.	F , 5
2.	I , 2
3.	K , 5
4.	H , 5
5.	A , 4
6.	L , 5
7.	G , 2
8.	B , 5
9.	J , 5
10.	C , 3
11.	E , 3

1-10	91	82	73	64	55	45	36	27	18	9
11	0									

Заполнение и согласование уравнений объема Имя:

Сопоставьте каждую проблему с уравнением, которое могло бы ее представить. Ответьте с пропущенным термином и буквой.

об) 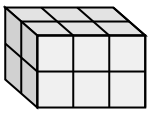

1) 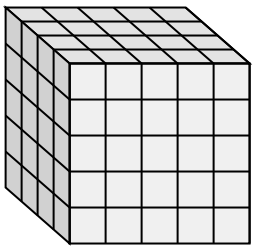

2) 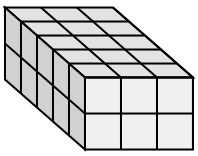

3) 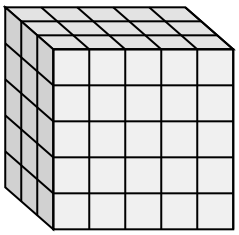

4) 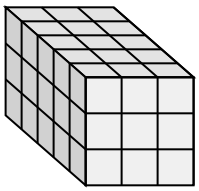

5) 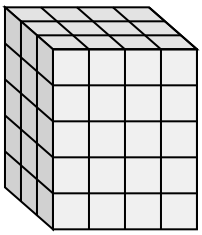

6) 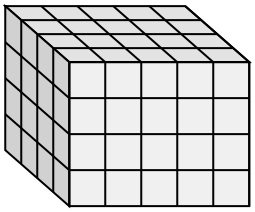

7) 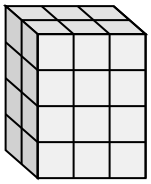

8) 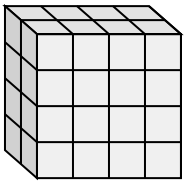

9) 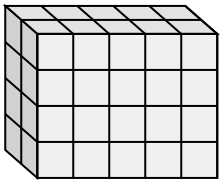

10) 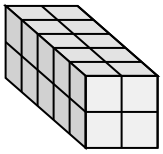

11) 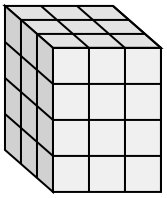

A. 3 × ___ × 5 = 60

B. ___ × 3 × 2 = 12

C. 2 × ___ × 4 = 40

D. 2 × 3 × ___ = 24

E. 4 × 5 × ___ = 80

F. ___ × 3 × 3 = 45

G. 5 × 2 × ___ = 20

H. 3 × 5 × 5 = ___

I. 4 × 5 × ___ = 100

J. ___ × 3 × 4 = 36

K. 5 × 3 × 2 = ___

L. ___ × 4 × 4 = 32

Ответы

об. **B , 2**

1. _____

2. _____

3. _____

4. _____

5. _____

6. _____

7. _____

8. _____

9. _____

10. _____

11. _____

1-10	91	82	73	64	55	45	36	27	18	9
11	0									

Заполнение и согласование уравнений объема Имя: Ключ к правильным ответам

Сопоставьте каждую проблему с уравнением, которое могло бы ее представить. Ответьте с пропущенным термином и буквой.

об) 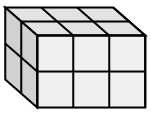

1) 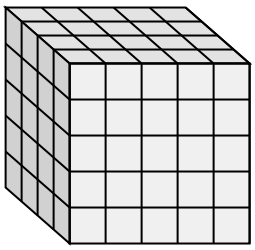

2) 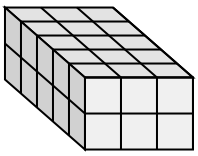

3) 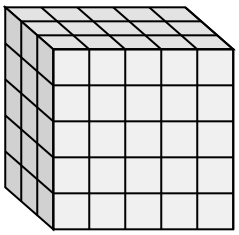

4) 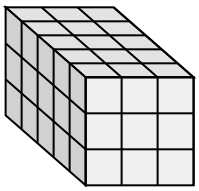

5) 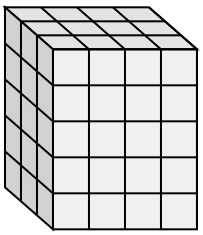

6) 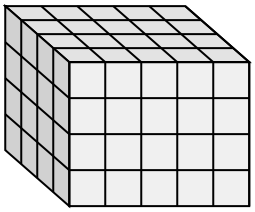

7) 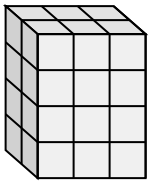

8) 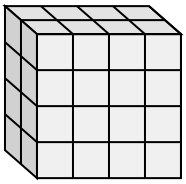

9) 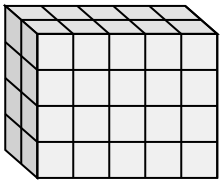

10) 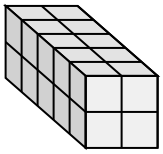

11) 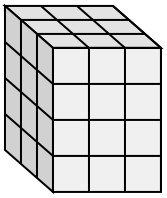

A. 3 × ___ × 5 = 60 **B.** ___ × 3 × 2 = 12 **C.** 2 × ___ × 4 = 40

D. 2 × 3 × ___ = 24 **E.** 4 × 5 × ___ = 80 **F.** ___ × 3 × 3 = 45

G. 5 × 2 × ___ = 20 **H.** 3 × 5 × 5 = ___ **I.** 4 × 5 × ___ = 100

J. ___ × 3 × 4 = 36 **K.** 5 × 3 × 2 = ___ **L.** ___ × 4 × 4 = 32

Ответы

об. B , 2

1. I , 5

2. K , 30

3. H , 75

4. F , 5

5. A , 4

6. E , 4

7. D , 4

8. L , 2

9. C , 5

10. G , 2

11. J , 3

1-10	91	82	73	64	55	45	36	27	18	9
11	0									

Заполнение и согласование уравнений объема Имя:

Сопоставьте каждую проблему с уравнением, которое могло бы ее представить. Ответьте с пропущенным термином и буквой.

об) 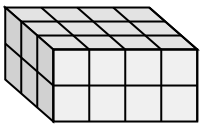

1) 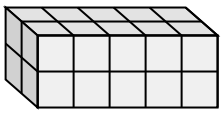

2) 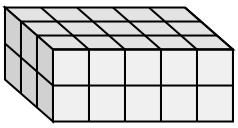

3) 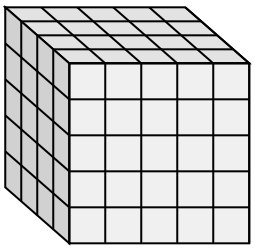

4) 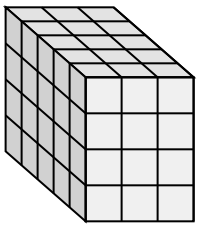

5) 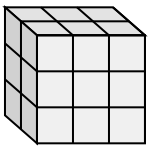

6) 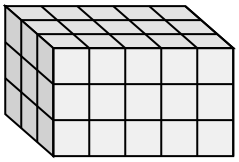

7) 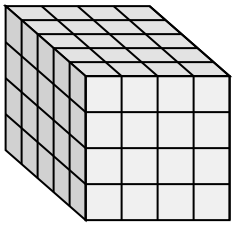

8) 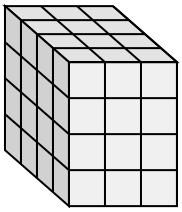

9) 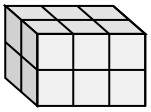

10) 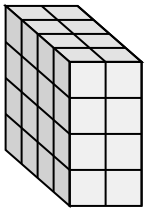

11) 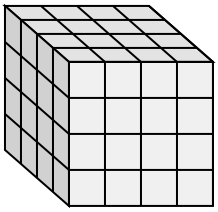

A. 4 × 3 × 4 = ___

B. ___ × 5 × 5 = 100

C. ___ × 3 × 2 = 12

D. ___ × 4 × 4 = 80

E. 5 × ___ × 4 = 60

F. ___ × 5 × 2 = 20

G. 4 × 4 × ___ = 64

H. 3 × ___ × 2 = 30

I. ___ × 2 × 4 = 32

J. 3 × 4 × 2 = ___

K. 3 × 5 × ___ = 45

L. 2 × 3 × ___ = 18

Ответы

об. J , 24

1. _____

2. _____

3. _____

4. _____

5. _____

6. _____

7. _____

8. _____

9. _____

10. _____

11. _____

1-10	91	82	73	64	55	45	36	27	18	9
11	0									

Заполнение и согласование уравнений объема Имя: Ключ к правильным ответам

Сопоставьте каждую проблему с уравнением, которое могло бы ее представить. Ответьте с пропущенным термином и буквой.

об) 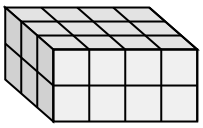

1) 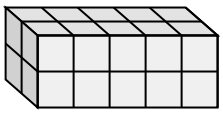

2) 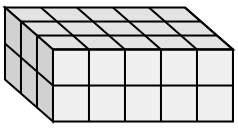

3) 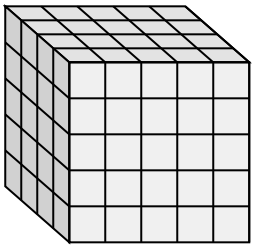

4) 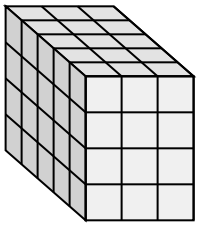

5) 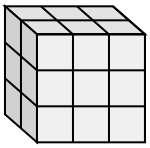

6) 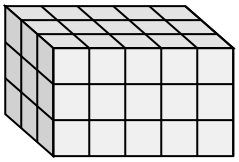

7) 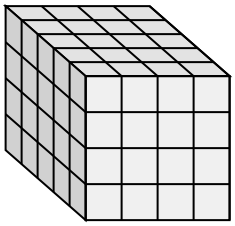

8) 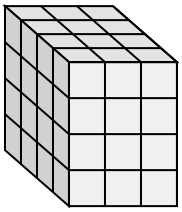

9) 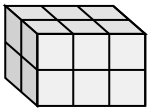

10) 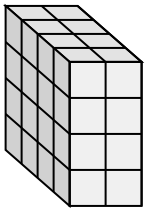

11) 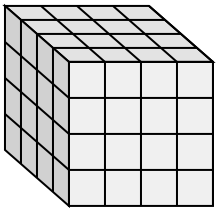

A. $4 \times 3 \times 4 =$ ___

B. ___ $\times 5 \times 5 = 100$

C. ___ $\times 3 \times 2 = 12$

D. ___ $\times 4 \times 4 = 80$

E. $5 \times$ ___ $\times 4 = 60$

F. ___ $\times 5 \times 2 = 20$

G. $4 \times 4 \times$ ___ $= 64$

H. $3 \times$ ___ $\times 2 = 30$

I. ___ $\times 2 \times 4 = 32$

J. $3 \times 4 \times 2 =$ ___

K. $3 \times 5 \times$ ___ $= 45$

L. $2 \times 3 \times$ ___ $= 18$

Ответы

об. J , 24

1. F , 2

2. H , 5

3. B , 4

4. E , 3

5. L , 3

6. K , 3

7. D , 5

8. A , 48

9. C , 2

10. I , 4

11. G , 4

1-10	91	82	73	64	55	45	36	27	18	9
11	0									