Определение расстояния в системе координат Имя:

Найдите расстояние между точками.

об)

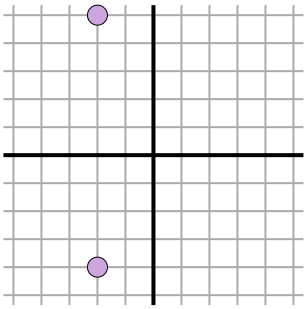

1)

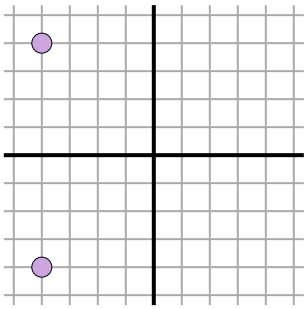

2)

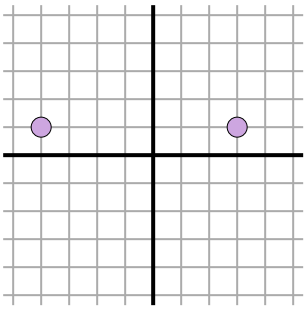

3)

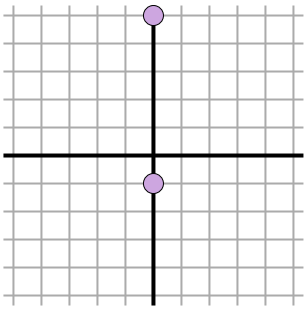

4)

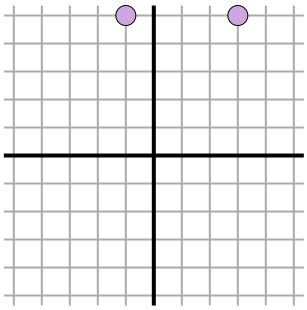

5)

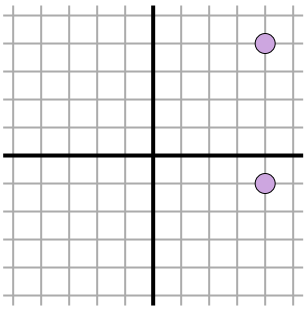

6)

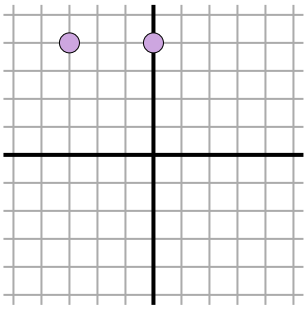

7)

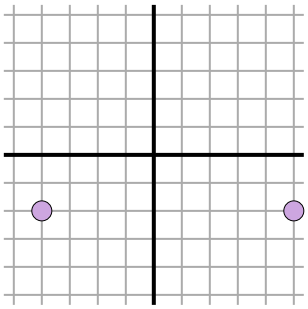

8)

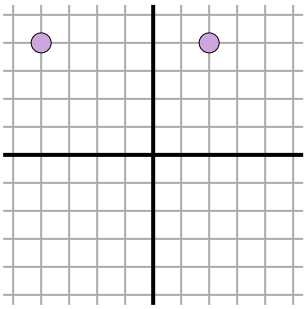

9)

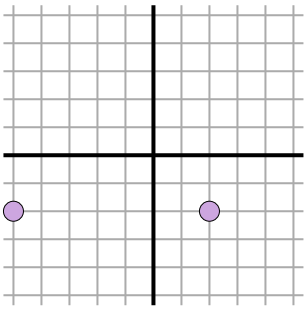

10)

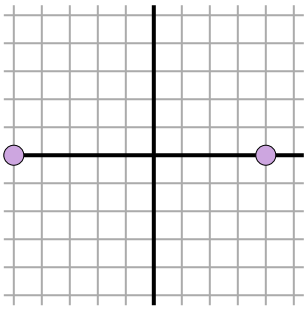

11)

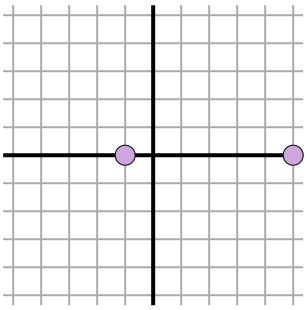

Ответы

об. 9

1. _____

2. _____

3. _____

4. _____

5. _____

6. _____

7. _____

8. _____

9. _____

10. _____

11. _____

1-10	91	82	73	64	55	45	36	27	18	9
11	0									

Определение расстояния в системе координат Имя: Ключ к правильным ответам

Найдите расстояние между точками.

об)

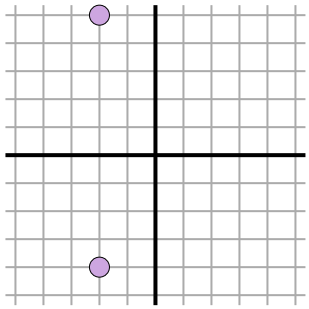

$\sqrt{(-2--2)^2 + (5--4)^2}$

$\sqrt{(0) + (81)}$

1)

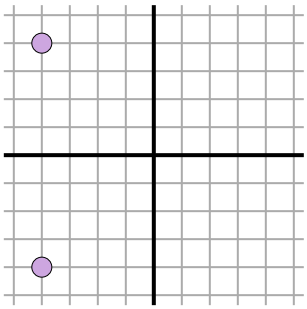

$\sqrt{(-4--4)^2 + (-4-4)^2}$

$\sqrt{(0) + (64)}$

2)

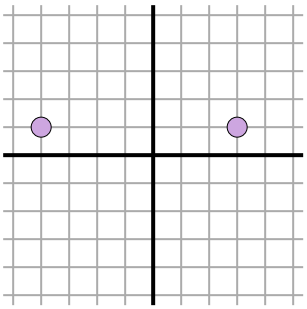

$\sqrt{(-4-3)^2 + (1-1)^2}$

$\sqrt{(49) + (0)}$

3)

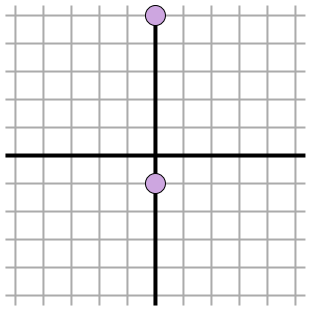

$\sqrt{(0-0)^2 + (5--1)^2}$

$\sqrt{(0) + (36)}$

4)

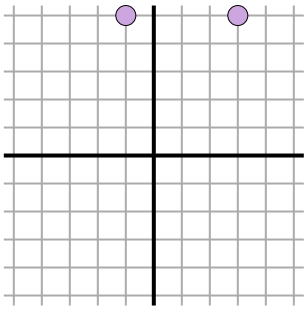

$\sqrt{(3--1)^2 + (5-5)^2}$

$\sqrt{(16) + (0)}$

5)

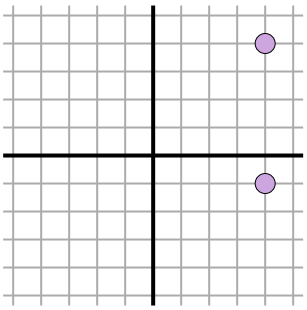

$\sqrt{(4-4)^2 + (4--1)^2}$

$\sqrt{(0) + (25)}$

6)

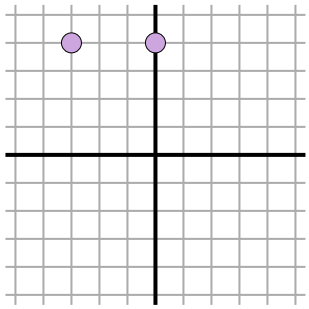

$\sqrt{(-3-0)^2 + (4-4)^2}$

$\sqrt{(9) + (0)}$

7)

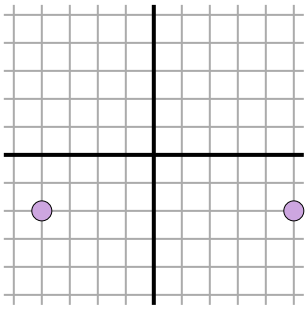

$\sqrt{(-4-5)^2 + (-2--2)^2}$

$\sqrt{(81) + (0)}$

8)

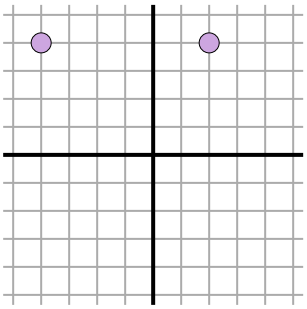

$\sqrt{(-4-2)^2 + (4-4)^2}$

$\sqrt{(36) + (0)}$

9)

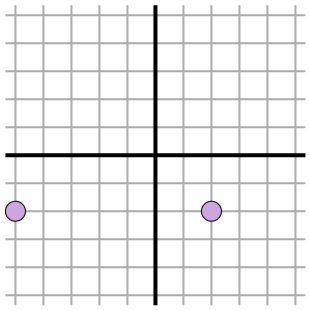

$\sqrt{(2--5)^2 + (-2--2)^2}$

$\sqrt{(49) + (0)}$

10)

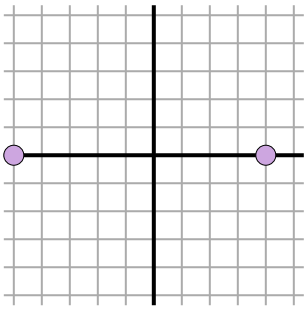

$\sqrt{(-5-4)^2 + (0-0)^2}$

$\sqrt{(81) + (0)}$

11)

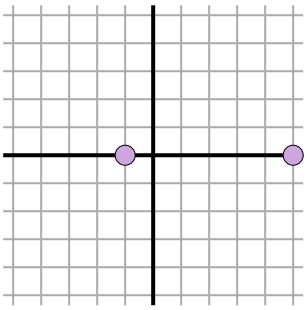

$\sqrt{(-1-5)^2 + (0-0)^2}$

$\sqrt{(36) + (0)}$

Ответы

об.	9
1.	8
2.	7
3.	6
4.	4
5.	5
6.	3
7.	9
8.	6
9.	7
10.	9
11.	6

1-10	91	82	73	64	55	45	36	27	18	9
11	0									