Измерьте каждый ЭЛЕМЕНТ от наконечника до наконечника, затем поместите результаты на линейный график.

об)

1)



2)



3)

4)

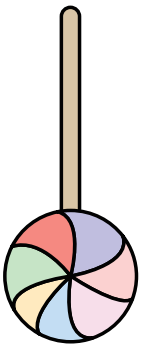

5)



6)

7)



8)



9)

10)

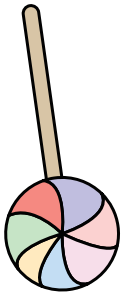

11)



Line Plot							
¼	½	¾	1	1 ¼	1 ½	1 ¾	2

Ответы

об. 1

1. _____

2. _____

3. _____

4. _____

5. _____

6. _____

7. _____

8. _____

9. _____

10. _____

11. _____

1-10	91	82	73	64	55	45	36	27	18	9
11	0									

Измерьте каждый ЭЛЕМЕНТ от наконечника до наконечника, затем поместите результаты на линейный график.

об)

1)



2)



3)

4)

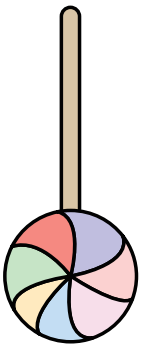

5)



6)

7)



8)



9)

10)

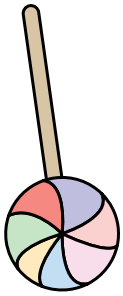

11)



Line Plot

		X	X		X		X
X	X	X	X	X	X	X	X
¼	½	¾	1	1 ¼	1 ½	1 ¾	2

Ответы

об.	1
1.	1 ½
2.	2
3.	½
4.	1 ¾
5.	¾
6.	¼
7.	1 ¼
8.	2
9.	1
10.	1 ½
11.	¾

1-10	91	82	73	64	55	45	36	27	18	9
11	0									