Выражение неравенств на цифровой прямой Имя:

**Используйте цифровую прямую, чтобы выразить неравенства.**

**об)** $X \geq -27$

-32 -31 -30 -29 -28 -27 -26 -25 -24 -23 -22 -21 -20

**1)** $X < 140$

134 135 136 137 138 139 140 141 142 143 144 145 146 147

**2)** $X \leq 54$

48 49 50 51 52 53 54 55 56 57 58 59

**3)** $X \leq -190$

-197 -196 -195 -194 -193 -192 -191 -190 -189 -188 -187 -186 -185

**4)** $X < -120$

-180 -170 -160 -150 -140 -130 -120 -110 -100 -90 -80 -70

**5)** $X \geq 117$

112 113 114 115 116 117 118 119 120 121 122 123 124

**6)** $X \leq 50$

-20 -10 0 10 20 30 40 50 60 70 80 90 100 110 120

**7)** $X \geq -70$

-95 -90 -85 -80 -75 -70 -65 -60 -55 -50 -45

**8)** $X > 35$

10 15 20 25 30 35 40 45 50 55 60

**9)** $X > -170$

-240 -230 -220 -210 -200 -190 -180 -170 -160 -150 -140 -130 -120 -110 -100

**10)** $X > -150$

-200 -190 -180 -170 -160 -150 -140 -130 -120 -110 -100

**11)** $X > -90$

-96 -95 -94 -93 -92 -91 -90 -89 -88 -87 -86 -85 -84

**12)** $X \geq 65$

40 45 50 55 60 65 70 75 80 85 90 95 100

**13)** $X > -5$

-40 -35 -30 -25 -20 -15 -10 -5 0 5 10 15 20 25 30



| | | | | | | | | | | |
|---|---|---|---|---|---|---|---|---|---|---|
| 1-10 | 92 | 85 | 77 | 69 | 62 | 54 | 46 | 38 | 31 | 23 |
| 11-13 | 15 | 8 | 0 | | | | | | | |

Выражение неравенств на цифровой прямой Имя: **Ключ к правильным ответам**

**Используйте цифровую прямую, чтобы выразить неравенства.**

**об)** $X \geq -27$

**1)** $X < 140$

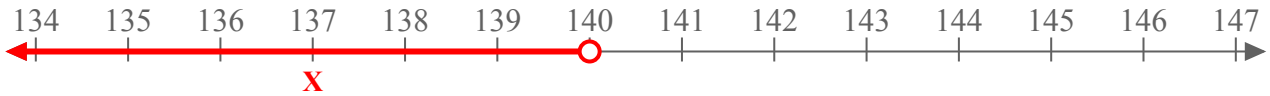


**2)** $X \leq 54$

**3)** $X \leq -190$

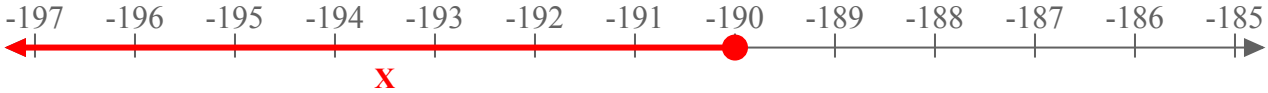


**4)** $X < -120$

**5)** $X \geq 117$

**6)** $X \leq 50$

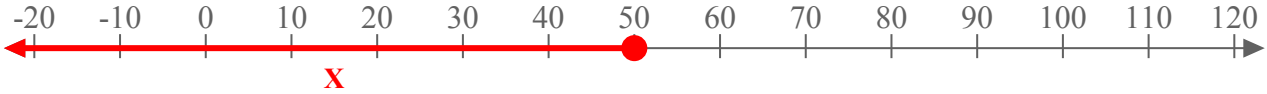


**7)** $X \geq -70$

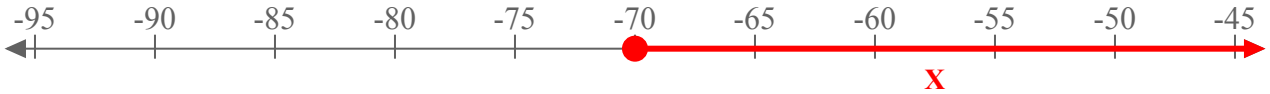


**8)** $X > 35$

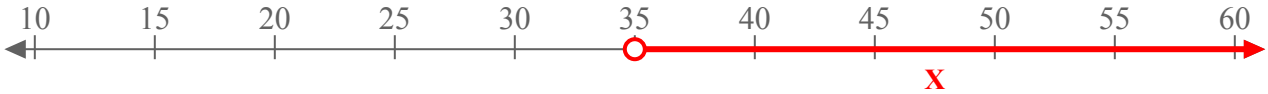


**9)** $X > -170$

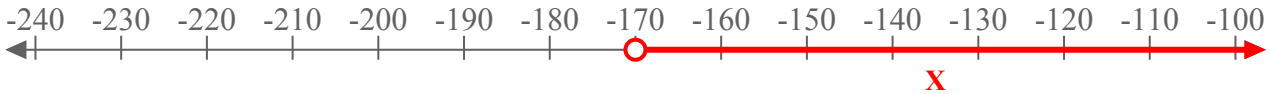


**10)** $X > -150$

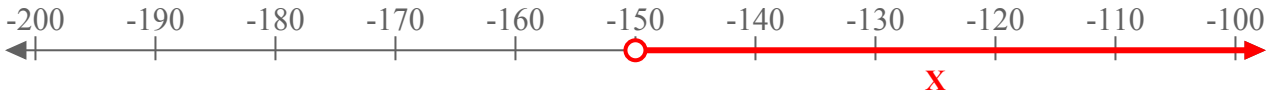


**11)** $X > -90$

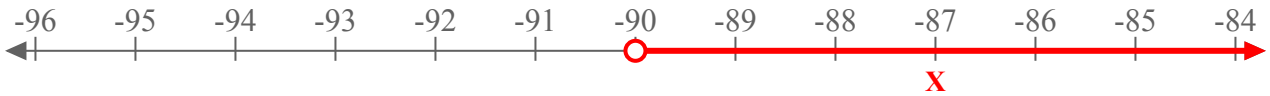


**12)** $X \geq 65$

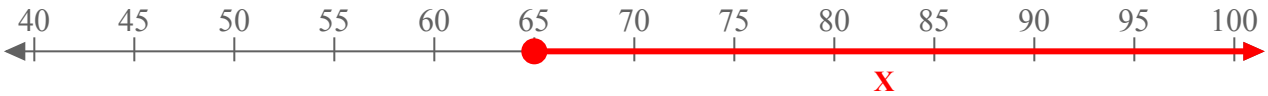


**13)** $X > -5$

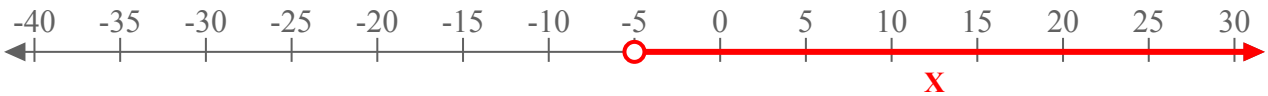




| | | | | | | | | | | |
|---|---|---|---|---|---|---|---|---|---|---|
| 1-10 | 92 | 85 | 77 | 69 | 62 | 54 | 46 | 38 | 31 | 23 |
| 11-13 | 15 | 8 | 0 | | | | | | | |