Выражение неравенств на цифровой прямой Имя:

Используйте цифровую прямую, чтобы выразить неравенства.

об) $X < -20$

-70 -60 -50 -40 -30 -20 -10 0 10 20 30

1) $X > -150$

-185 -180 -175 -170 -165 -160 -155 -150 -145 -140 -135 -130 -125 -120

2) $X \leq 50$

0 10 20 30 40 50 60 70 80 90 100

3) $X > -120$

-180 -170 -160 -150 -140 -130 -120 -110 -100 -90 -80 -70 -60

4) $X < 184$

177 178 179 180 181 182 183 184 185 186 187 188 189 190

5) $X < 40$

15 20 25 30 35 40 45 50 55 60 65 70 75

6) $X \geq -119$

-124 -123 -122 -121 -120 -119 -118 -117 -116 -115 -114 -113

7) $X \geq -110$

-170 -160 -150 -140 -130 -120 -110 -100 -90 -80 -70 -60

8) $X < 17$

10 11 12 13 14 15 16 17 18 19 20 21 22

9) $X \leq -55$

-61 -60 -59 -58 -57 -56 -55 -54 -53 -52 -51 -50 -49 -48

10) $X < -50$

-120 -110 -100 -90 -80 -70 -60 -50 -40 -30 -20 -10 0 10 20

11) $X \leq -85$

-110 -105 -100 -95 -90 -85 -80 -75 -70 -65 -60 -55 -50

12) $X \leq 50$

43 44 45 46 47 48 49 50 51 52 53 54 55 56

13) $X \geq 165$

135 140 145 150 155 160 165 170 175 180 185 190 195 200

1-10	92	85	77	69	62	54	46	38	31	23
11-13	15	8	0							

Выражение неравенств на цифровой прямой Имя: **Ключ к правильным ответам**

Используйте цифровую прямую, чтобы выразить неравенства.

об) X < -20

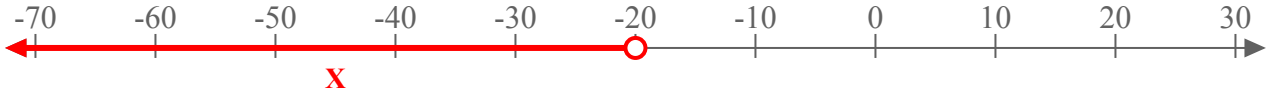

1) X > -150

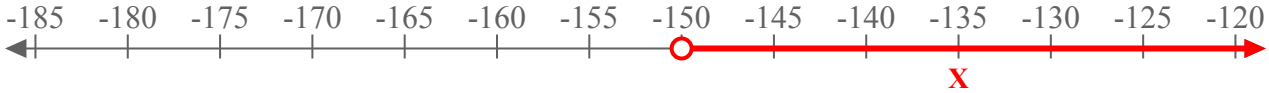

2) X ≤ 50

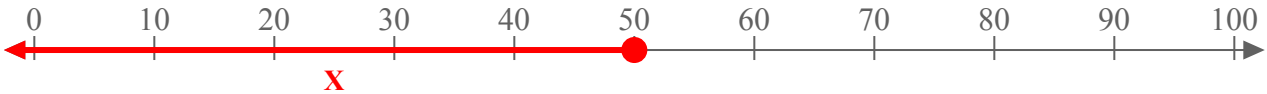

3) X > -120

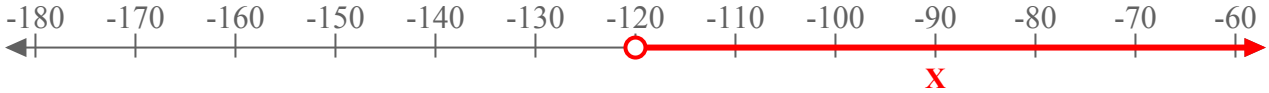

4) X < 184

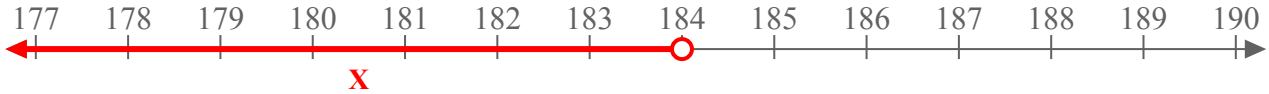

5) X < 40

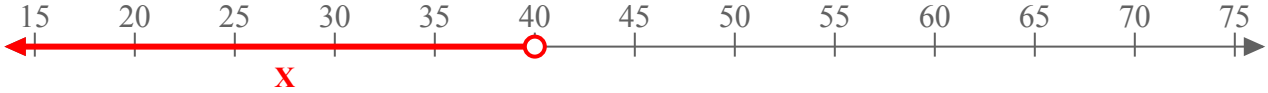

6) X ≥ -119

7) X ≥ -110

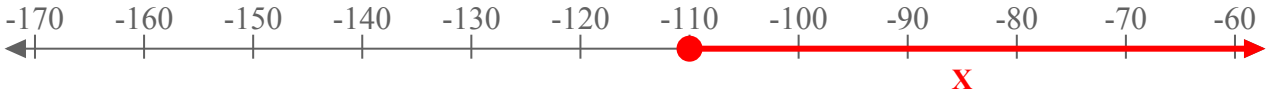

8) X < 17

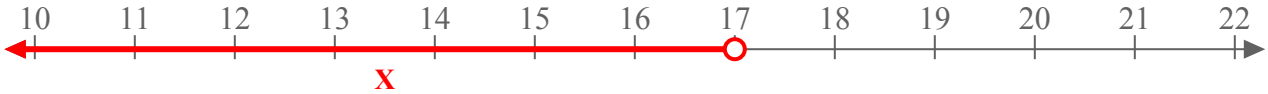

9) X ≤ -55

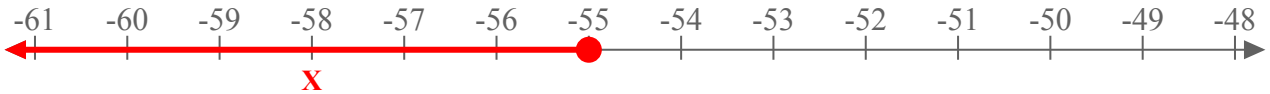

10) X < -50

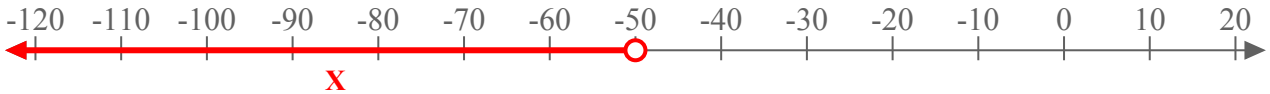

11) X ≤ -85

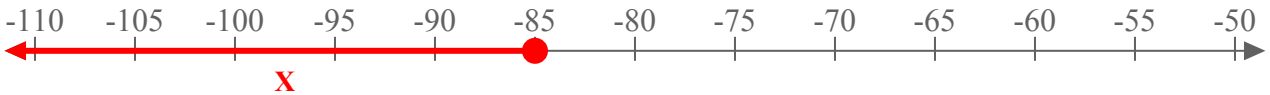

12) X ≤ 50

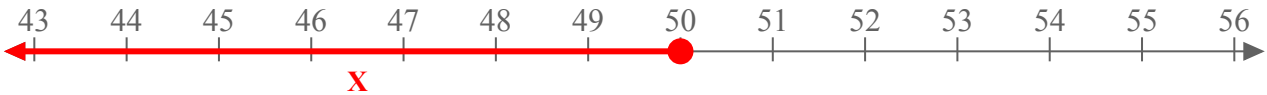

13) X ≥ 165

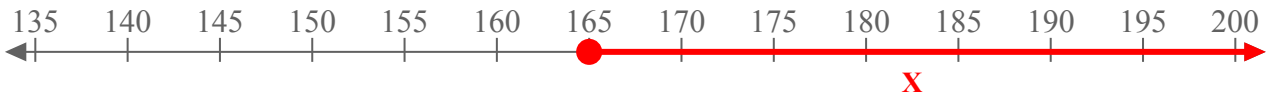

1-10	92	85	77	69	62	54	46	38	31	23
11-13	15	8	0							