Написание задач на умножение (визуальное) Имя:

Перепишите каждую матрицу в виде умножения и решите.

об)



1)

2)



3)

4)



5)



6)



7)



8)



9)

10)



11)

Ответы

об. 7 × 7 = 49

1. _____

2. _____

3. _____

4. _____

5. _____

6. _____

7. _____

8. _____

9. _____

10. _____

11. _____

1-10	91	82	73	64	55	45	36	27	18	9
11	0									

Написание задач на умножение (визуальное) Имя: **Ключ к правильным ответам**

Перепишите каждую матрицу в виде умножения и решите.

об)



1)

2)



3)

4)



5)



6)



7)



8)



9)

10)



11)

Ответы

об. 7 × 7 = 49

1. 8 × 6 = 48

2. 6 × 8 = 48

3. 5 × 2 = 10

4. 10 × 8 = 80

5. 8 × 2 = 16

6. 9 × 10 = 90

7. 3 × 8 = 24

8. 8 × 9 = 72

9. 3 × 9 = 27

10. 9 × 9 = 81

11. 6 × 4 = 24

1-10	91	82	73	64	55	45	36	27	18	9
11	0									