Написание задач на умножение (визуальное) Имя:

Перепишите каждую матрицу в виде умножения и решите.

об)

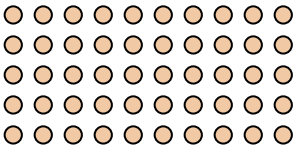

1)



2)



3)



4)

5)



6)

7)



8)

9)



10)



11)



Ответы

об. $5 \times 10 = 50$

1. _____

2. _____

3. _____

4. _____

5. _____

6. _____

7. _____

8. _____

9. _____

10. _____

11. _____

Написание задач на умножение (визуальное) Имя: **Ключ к правильным ответам**

Перепишите каждую матрицу в виде умножения и решите.

об)

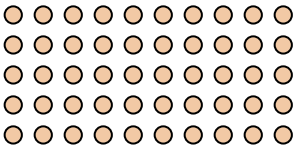

1)



2)



3)



4)

5)



6)

7)



8)

9)



10)



11)



Ответы

об. 5 × 10 = 50

1. 8 × 7 = 56

2. 10 × 9 = 90

3. 6 × 6 = 36

4. 10 × 4 = 40

5. 4 × 8 = 32

6. 4 × 4 = 16

7. 7 × 9 = 63

8. 2 × 5 = 10

9. 10 × 6 = 60

10. 4 × 7 = 28

11. 3 × 8 = 24

1-10	91	82	73	64	55	45	36	27	18	9
11	0									