Визуальный вес разряда (в пределах 20) Имя:

Заполните пропуски.

об)

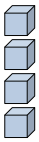

0 десятками 4 единицами

1)

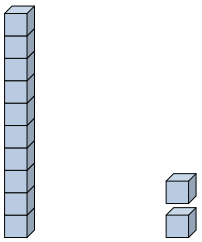

_____ десятками _____ единицами

2)

_____ десятками _____ единицами

3)

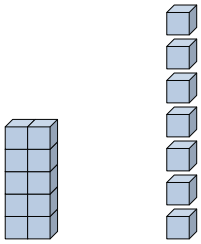

_____ десятками _____ единицами

4)

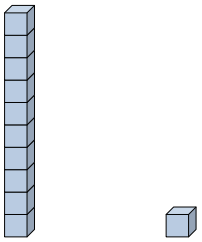

_____ десятками _____ единицами

5)

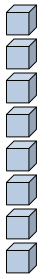

_____ десятками _____ единицами

6)

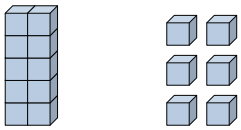

_____ десятками _____ единицами

7)

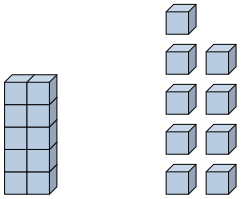

_____ десятками _____ единицами

8)

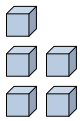

_____ десятками _____ единицами

9)

_____ десятками _____ единицами

10)

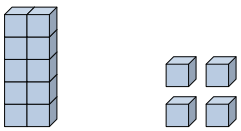

_____ десятками _____ единицами

11)

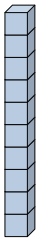

_____ десятками _____ единицами

Ответы

об. 4

1. _____

2. _____

3. _____

4. _____

5. _____

6. _____

7. _____

8. _____

9. _____

10. _____

11. _____

1-10	91	82	73	64	55	45	36	27	18	9
11	0									

Визуальный вес разряда (в пределах 20) Имя: Ключ к правильным ответам

Заполните пропуски.

об)

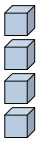

0 десятками 4 единицами

1)

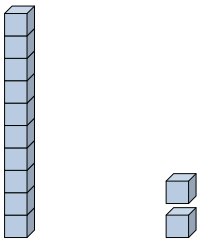

1 десятками 2 единицами

2)

0 десятками 1 единицами

3)

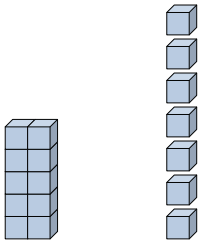

1 десятками 7 единицами

4)

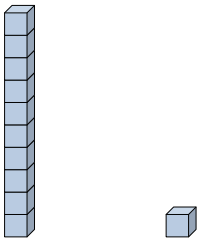

1 десятками 1 единицами

5)

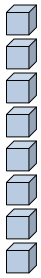

0 десятками 8 единицами

6)

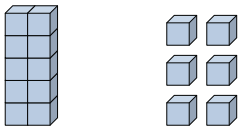

1 десятками 6 единицами

7)

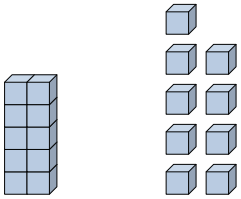

1 десятками 9 единицами

8)

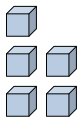

0 десятками 5 единицами

9)

0 десятками 3 единицами

10)

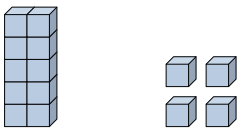

1 десятками 4 единицами

11)

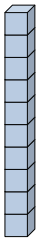

1 десятками 0 единицами

Ответы

об. 4
1. 12
2. 1
3. 17
4. 11
5. 8
6. 16
7. 19
8. 5
9. 3
10. 14
11. 10