Определение углов внутри фигур Имя:

Определите количество острых, тупых и прямых углов внутри каждой фигуры.

об)



1)

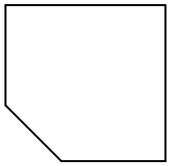

2)

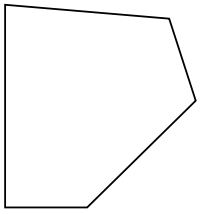

3)

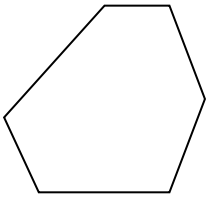

4)

5)

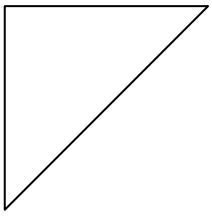

6)



7)

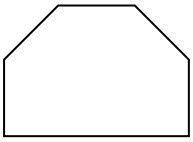

8)

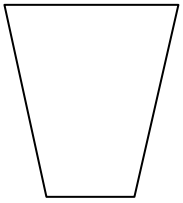

9)

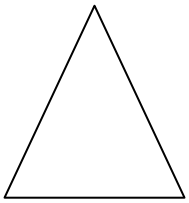

10)

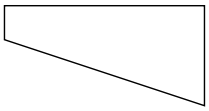

11)

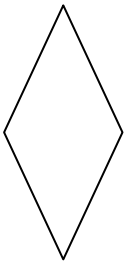

Ответы

об.	0	0	4
1.			
2.			
3.			
4.			
5.			
6.			
7.			
8.			
9.			
10.			
11.			

1-10	91	82	73	64	55	45	36	27	18	9
11	0									

Определение углов внутри фигур Имя: Ключ к правильным ответам

Определите количество острых, тупых и прямых углов внутри каждой фигуры.

об)

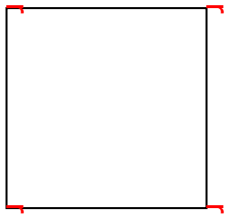

1)

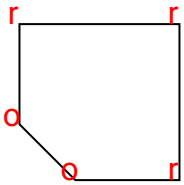

2)

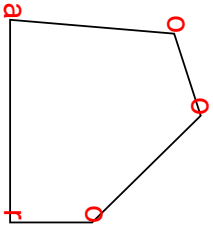

3)

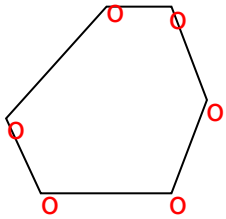

4)

5)

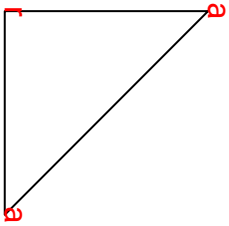

6)

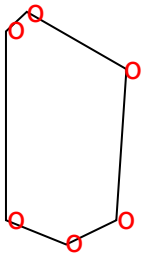

7)

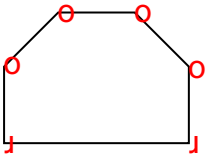

8)

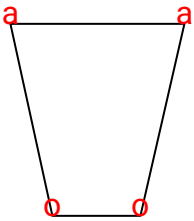

9)

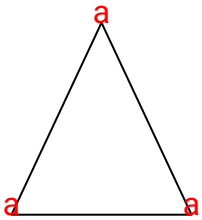

10)

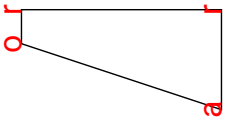

11)

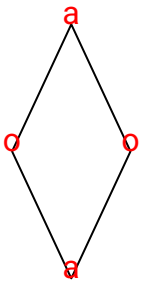

Ответы

об.	0	0	4
1.	0	2	3
2.	1	3	1
3.	0	6	0
4.	0	0	4
5.	2	0	1
6.	0	6	0
7.	0	4	2
8.	2	2	0
9.	3	0	0
10.	1	1	2
11.	2	2	0

1-10	91	82	73	64	55	45	36	27	18	9
11	0									