Определение углов внутри фигур Имя:

Определите количество острых, тупых и прямых углов внутри каждой фигуры.

об)

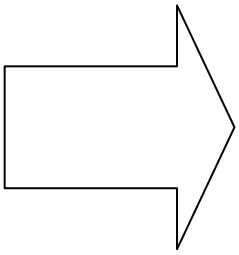

1)

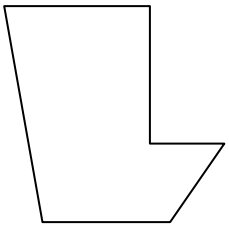

2)

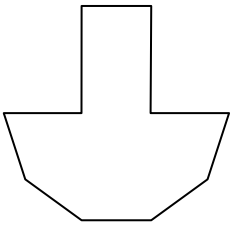

3)

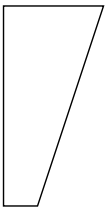

4)

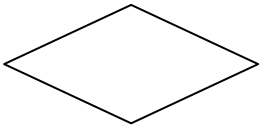

5)

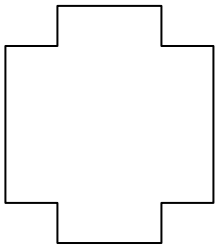

6)

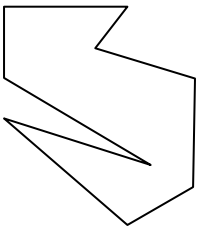

7)

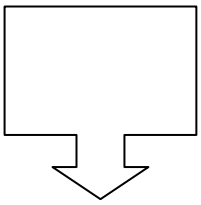

8)

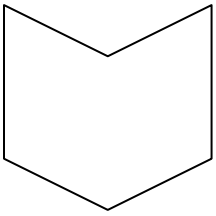

9)

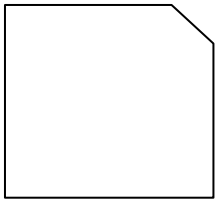

10)



11)

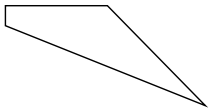

Ответы

об.	2	1	2	2
1.				
2.				
3.				
4.				
5.				
6.				
7.				
8.				
9.				
10.				
11.				

1-10	91	82	73	64	55	45	36	27	18	9
11	0									

Определение углов внутри фигур Имя: Ключ к правильным ответам

Определите количество острых, тупых и прямых углов внутри каждой фигуры.

об)

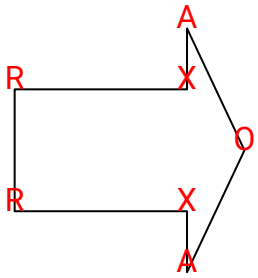

1)

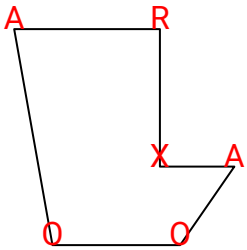

2)

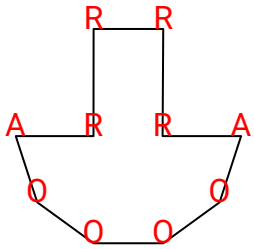

3)

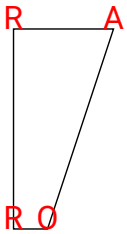

4)

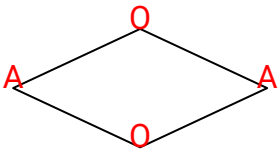

5)

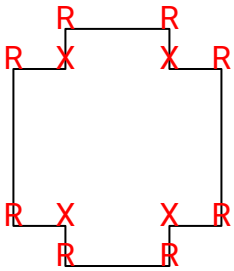

6)

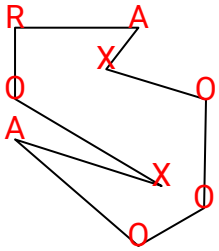

7)

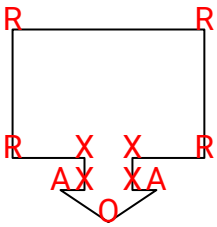

8)

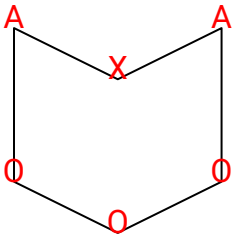

9)

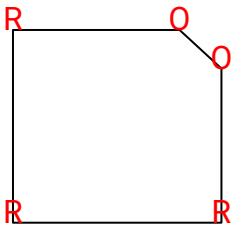

10)

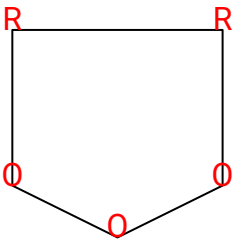

11)

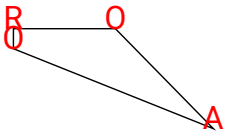

Ответы

об.	2	1	2	2
1.	2	2	1	1
2.	2	4	4	0
3.	1	1	2	0
4.	2	2	0	0
5.	0	0	8	4
6.	2	4	1	2
7.	2	1	4	4
8.	2	3	0	1
9.	0	2	3	0
10.	0	3	2	0
11.	1	2	1	0