Определение неизвестного угла Имя:

Определите значение угла 'A'.

1)

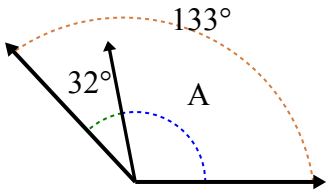

2)

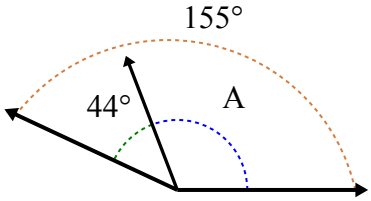

3)

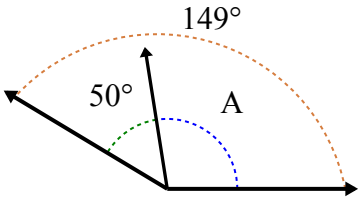

4)

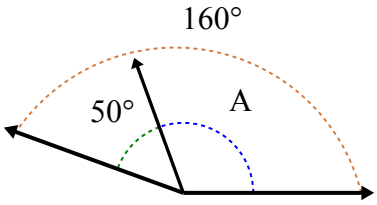

5)

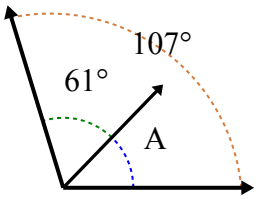

6)

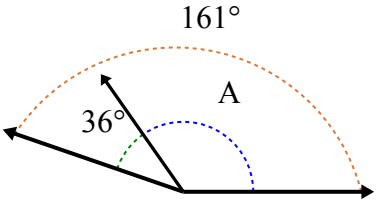

7)

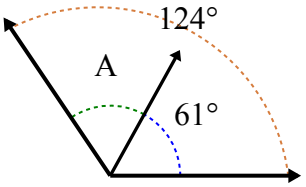

8)

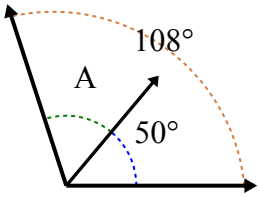

9)

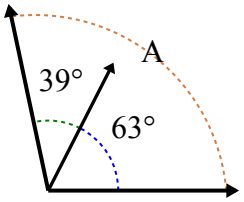

10)

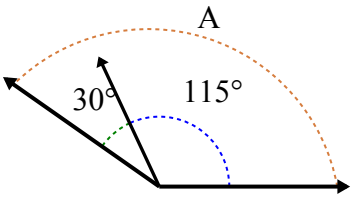

11)

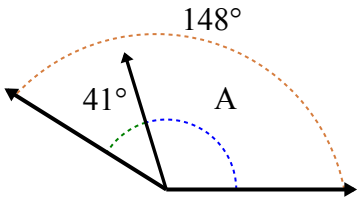

12)

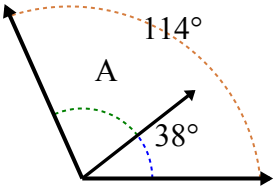

Ответы

1. _____
2. _____
3. _____
4. _____
5. _____
6. _____
7. _____
8. _____
9. _____
10. _____
11. _____
12. _____

1-10	92	83	75	67	58	50	42	33	25	17
11-12	8	0								

Определение неизвестного угла

Имя: **Ключ к правильным ответам**

Определите значение угла 'A'.

1)

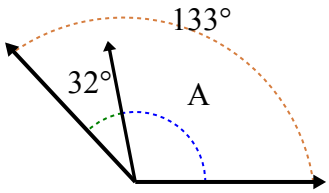

2)

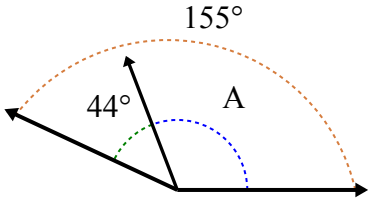

3)

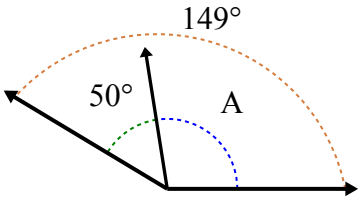

4)

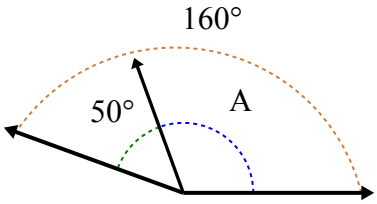

5)

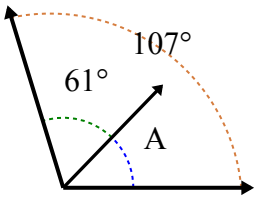

6)

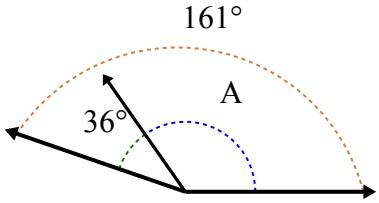

7)

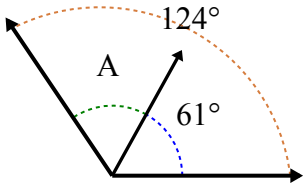

8)

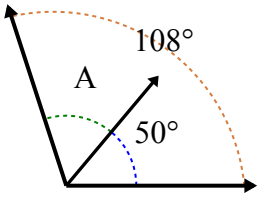

9)

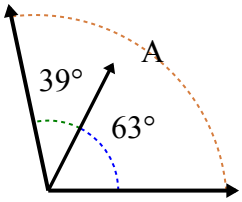

10)

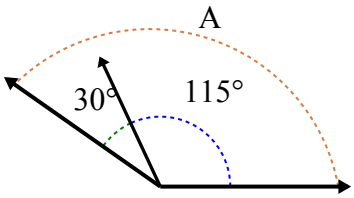

11)

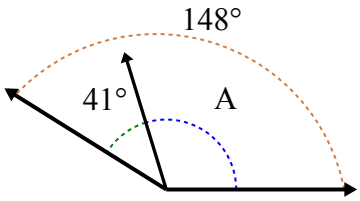

12)

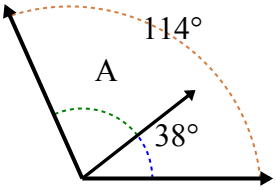

Ответы

1. **101**
2. **111**
3. **99**
4. **110**
5. **46**
6. **125**
7. **63**
8. **58**
9. **102**
10. **145**
11. **107**
12. **76**

1-10	92	83	75	67	58	50	42	33	25	17
11-12	8	0								

Определение неизвестного угла Имя:

Определите значение угла 'A'.

1)

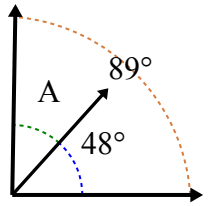

2)

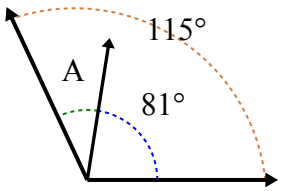

3)

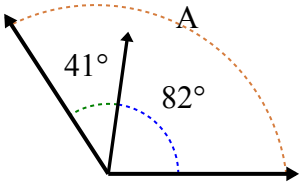

4)

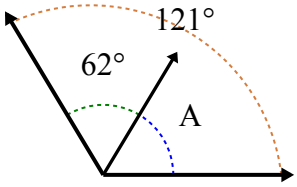

5)

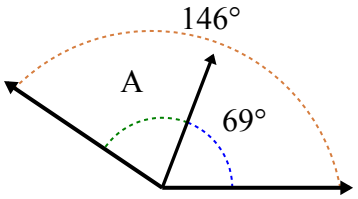

6)

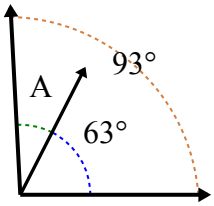

7)

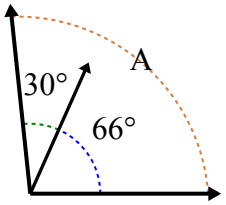

8)

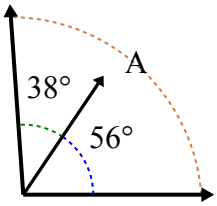

9)

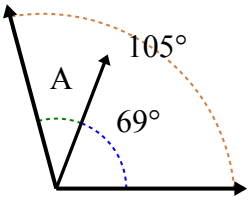

10)

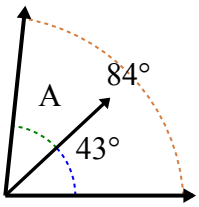

11)

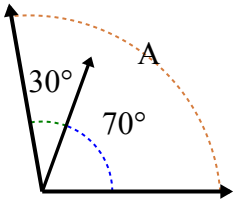

12)

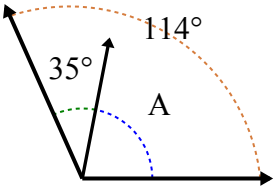

Ответы

1. _____
2. _____
3. _____
4. _____
5. _____
6. _____
7. _____
8. _____
9. _____
10. _____
11. _____
12. _____

1-10	92	83	75	67	58	50	42	33	25	17
11-12	8	0								

Определите значение угла 'A'.

1)

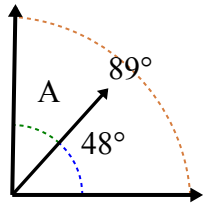

2)

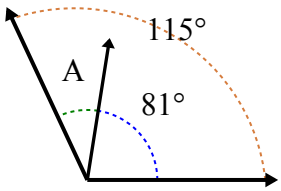

3)

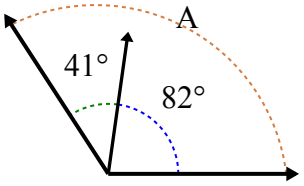

4)

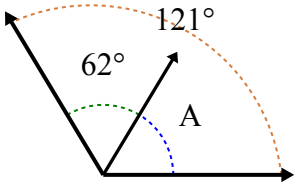

5)

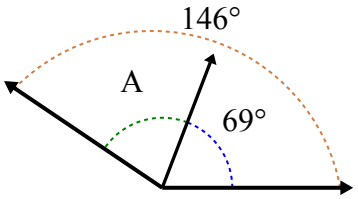

6)

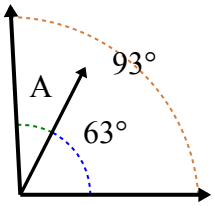

7)

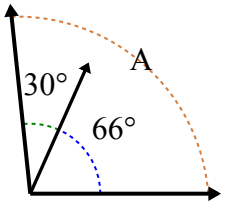

8)

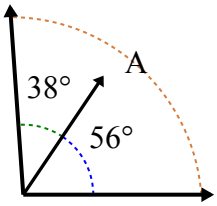

9)

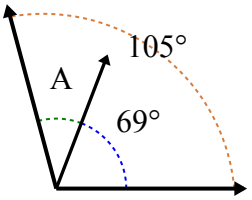

10)

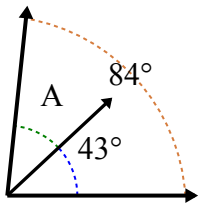

11)

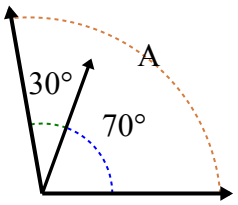

12)

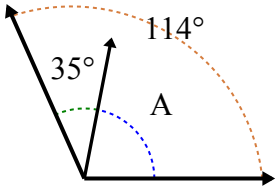

Ответы

1. 41
2. 34
3. 123
4. 59
5. 77
6. 30
7. 96
8. 94
9. 36
10. 41
11. 100
12. 79

1-10	92	83	75	67	58	50	42	33	25	17
11-12	8	0								

Определение неизвестного угла Имя:

Определите значение угла 'A'.

1)

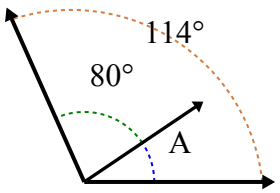

2)

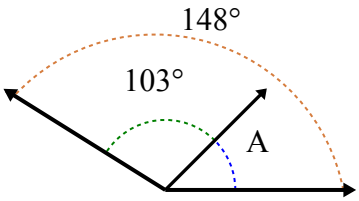

3)

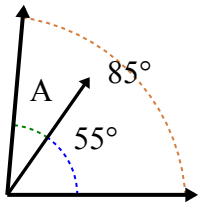

4)

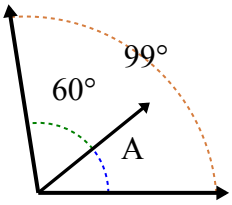

5)

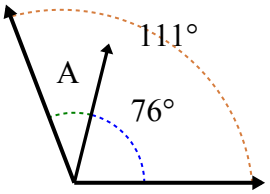

6)

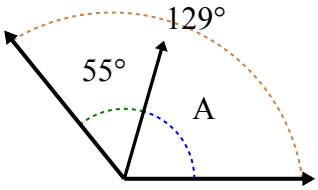

7)

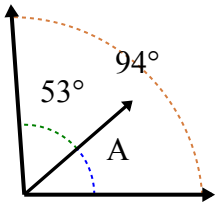

8)

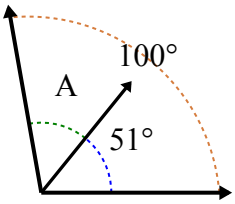

9)

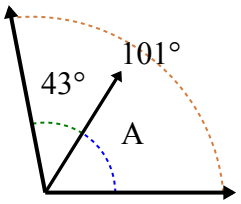

10)

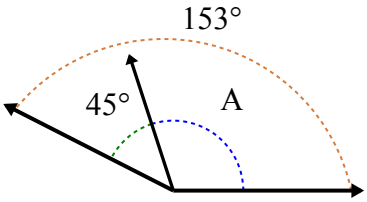

11)

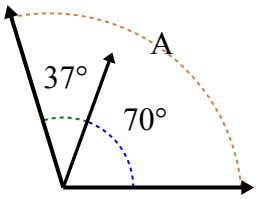

12)

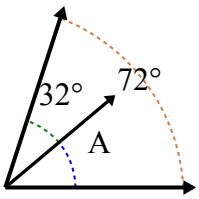

Ответы

1. _____
2. _____
3. _____
4. _____
5. _____
6. _____
7. _____
8. _____
9. _____
10. _____
11. _____
12. _____

1-10	92	83	75	67	58	50	42	33	25	17
11-12	8	0								

Определите значение угла 'A'.

1)

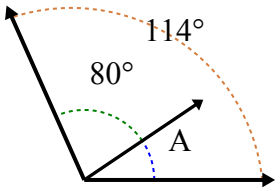

2)

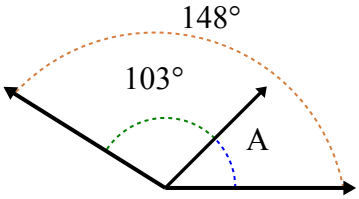

3)

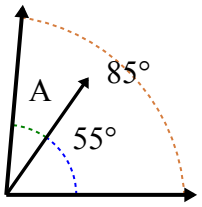

4)

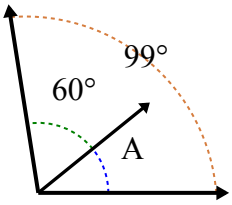

5)

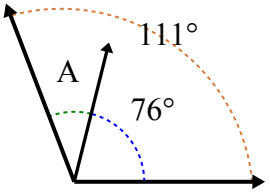

6)

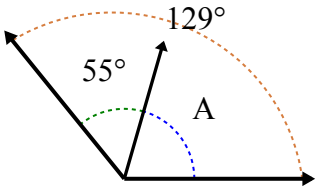

7)

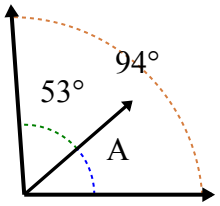

8)

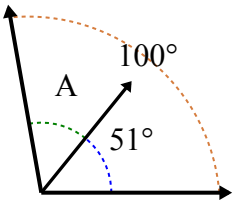

9)

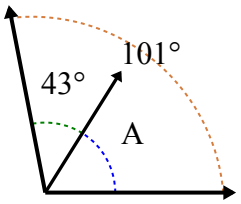

10)

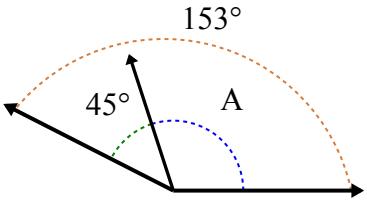

11)

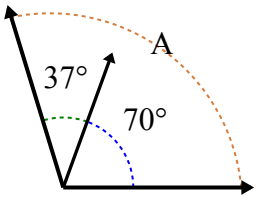

12)

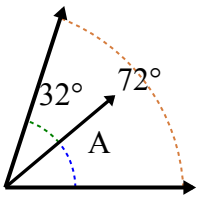

Ответы

1. 34
2. 45
3. 30
4. 39
5. 35
6. 74
7. 41
8. 49
9. 58
10. 108
11. 107
12. 40

1-10	92	83	75	67	58	50	42	33	25	17
11-12	8	0								

Определение неизвестного угла Имя:

Определите значение угла 'A'.

1)

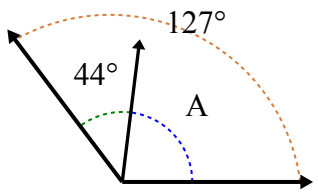

2)

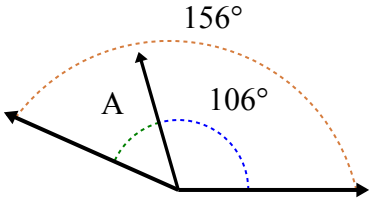

3)

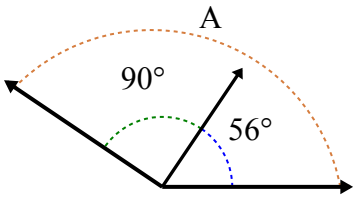

4)

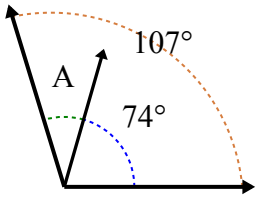

5)

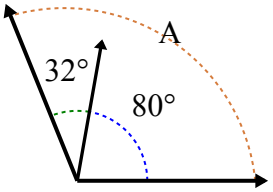

6)

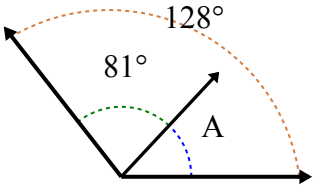

7)

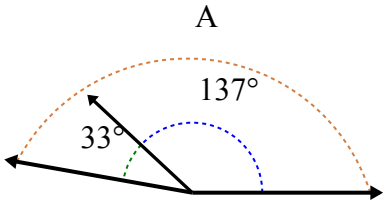

8)

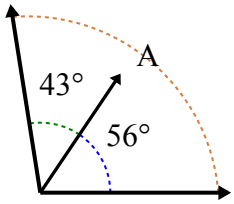

9)

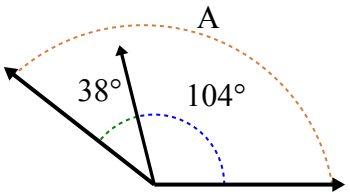

10)

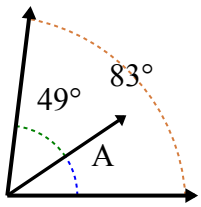

11)

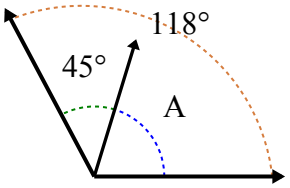

12)

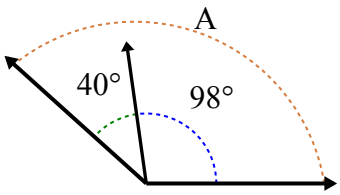

Ответы

1. _____
2. _____
3. _____
4. _____
5. _____
6. _____
7. _____
8. _____
9. _____
10. _____
11. _____
12. _____

1-10	92	83	75	67	58	50	42	33	25	17
11-12	8	0								

Определение неизвестного угла Имя: Ключ к правильным ответам

Определите значение угла 'A'.

1)

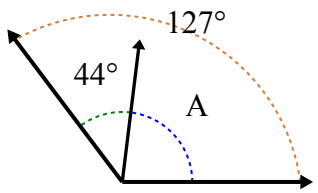

2)

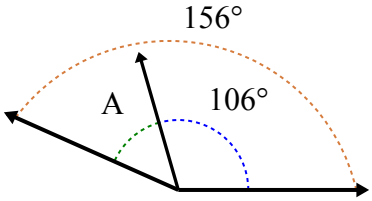

3)

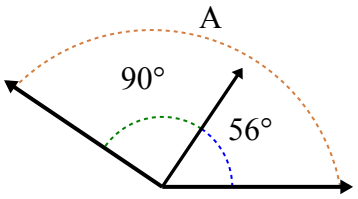

4)

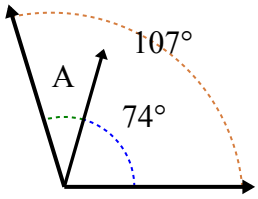

5)

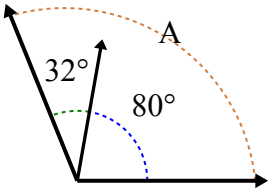

6)

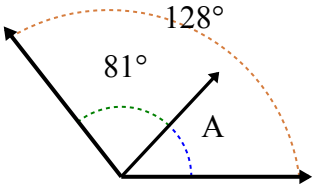

7)

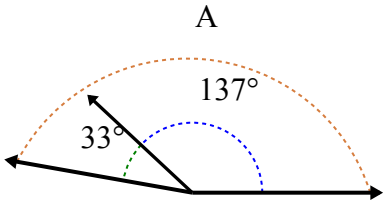

8)

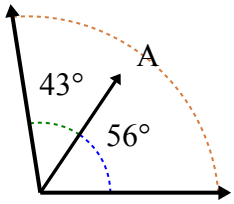

9)

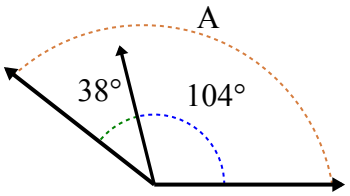

10)

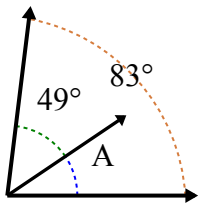

11)

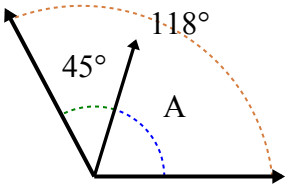

12)

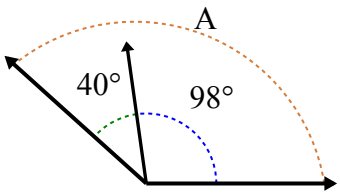

Ответы

1. 83
2. 50
3. 146
4. 33
5. 112
6. 47
7. 170
8. 99
9. 142
10. 34
11. 73
12. 138

1-10	92	83	75	67	58	50	42	33	25	17
11-12	8	0								

Определение неизвестного угла Имя:

Определите значение угла 'A'.

1)

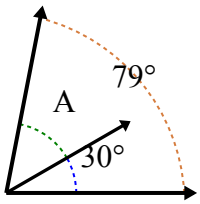

2)

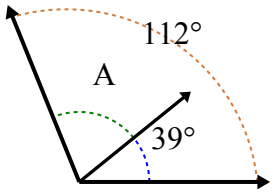

3)

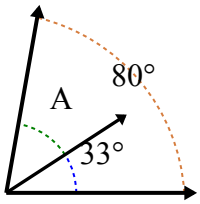

4)

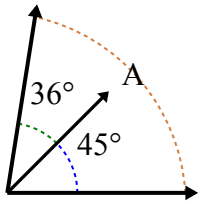

5)

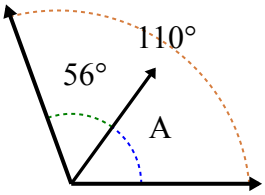

6)

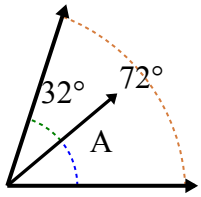

7)

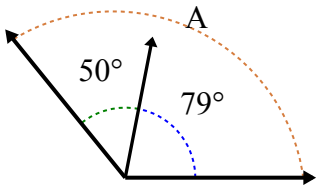

8)

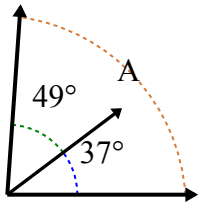

9)

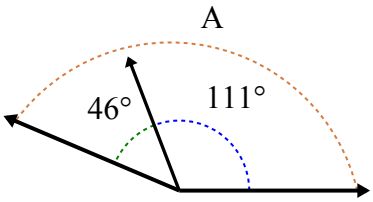

10)

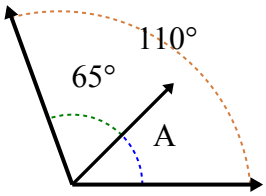

11)

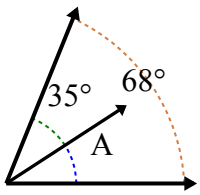

12)

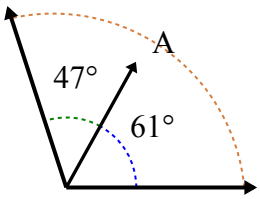

Ответы

1. _____
2. _____
3. _____
4. _____
5. _____
6. _____
7. _____
8. _____
9. _____
10. _____
11. _____
12. _____

1-10	92	83	75	67	58	50	42	33	25	17
11-12	8	0								

Определите значение угла 'A'.

1)

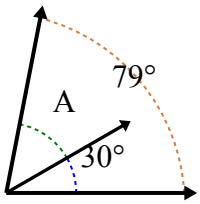

2)

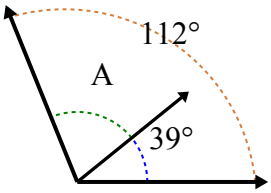

3)

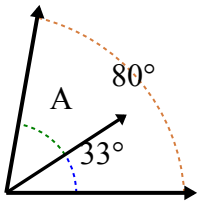

4)

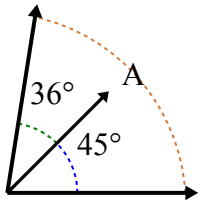

5)

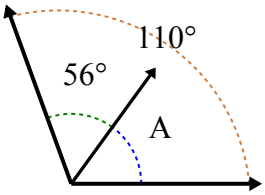

6)

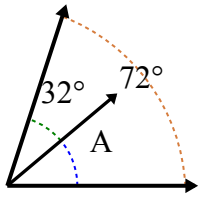

7)

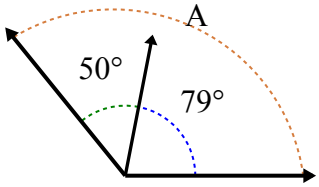

8)

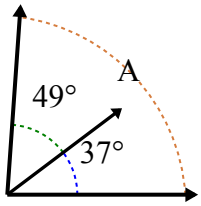

9)

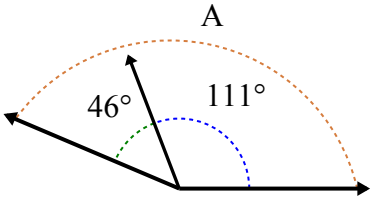

10)

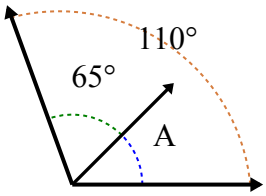

11)

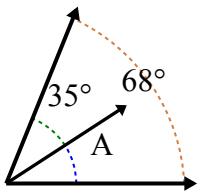

12)

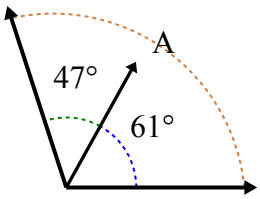

Ответы

1. 49
2. 73
3. 47
4. 81
5. 54
6. 40
7. 129
8. 86
9. 157
10. 45
11. 33
12. 108

1-10	92	83	75	67	58	50	42	33	25	17
11-12	8	0								

Определение неизвестного угла Имя:

Определите значение угла 'A'.

1)

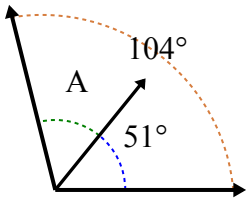

2)

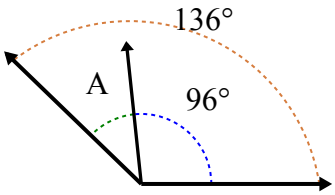

3)

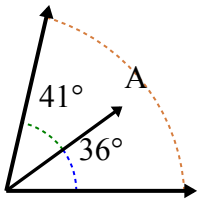

4)

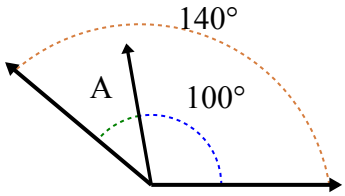

5)

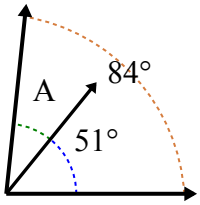

6)

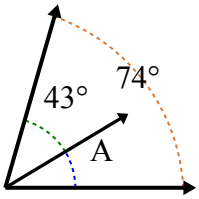

7)

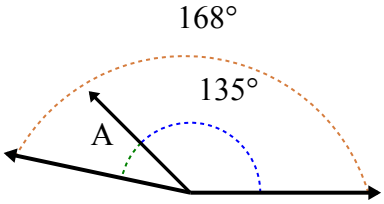

8)

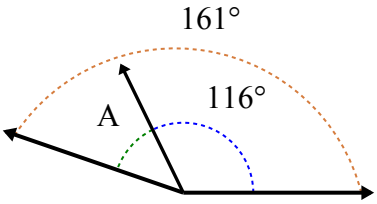

9)

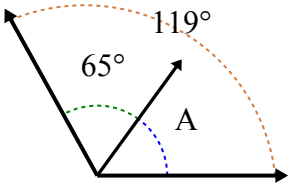

10)

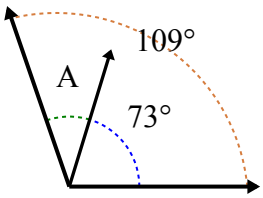

11)

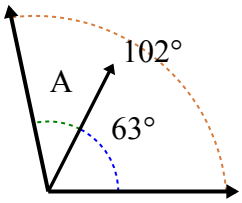

12)

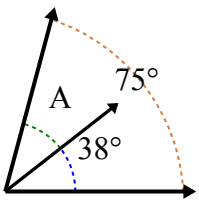

Ответы

1. _____
2. _____
3. _____
4. _____
5. _____
6. _____
7. _____
8. _____
9. _____
10. _____
11. _____
12. _____

1-10	92	83	75	67	58	50	42	33	25	17
11-12	8	0								

Определите значение угла 'A'.

1)
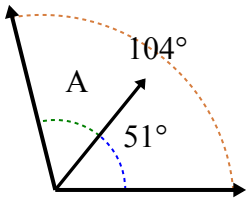

2)
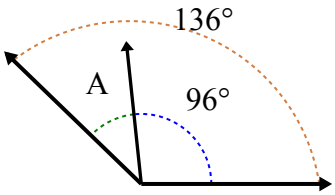

3)
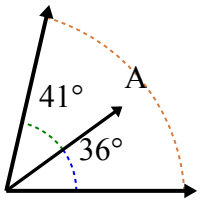

4)
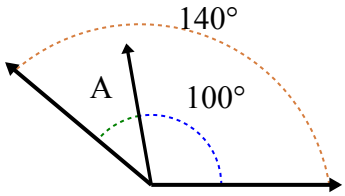

5)
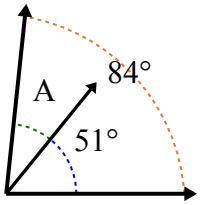

6)
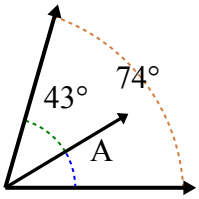

7)
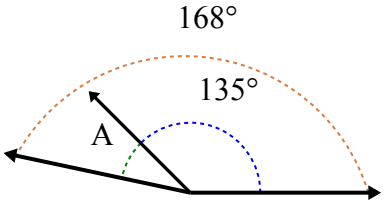

8)
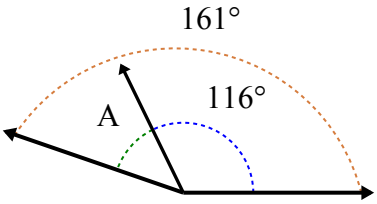

9)
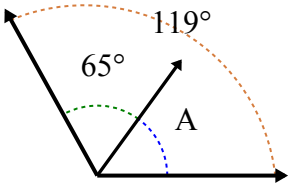

10)
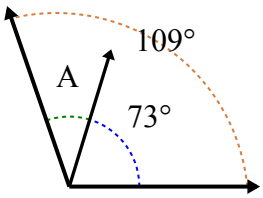

11)
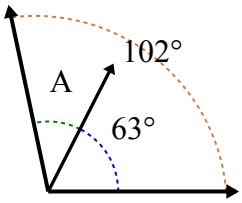

12)
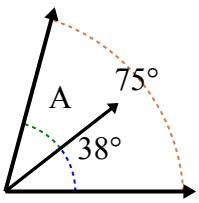

Ответы

1. 53
2. 40
3. 77
4. 40
5. 33
6. 31
7. 33
8. 45
9. 54
10. 36
11. 39
12. 37

1-10	92	83	75	67	58	50	42	33	25	17
11-12	8	0								

Определение неизвестного угла Имя:

Определите значение угла 'A'.

1)

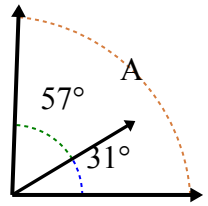

2)

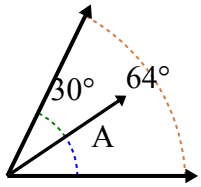

3)

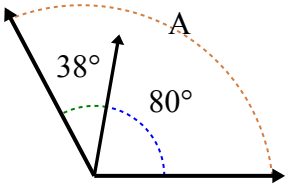

4)

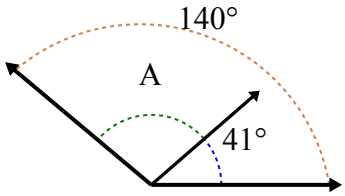

5)

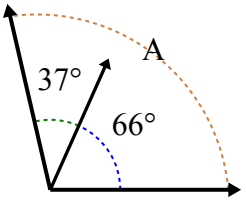

6)

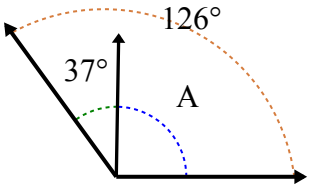

7)

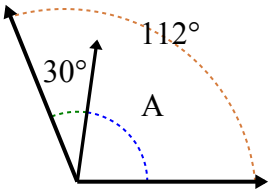

8)

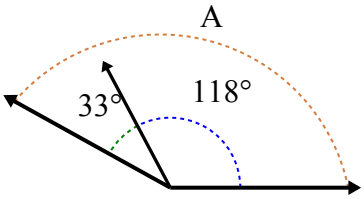

9)

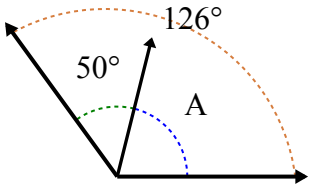

10)

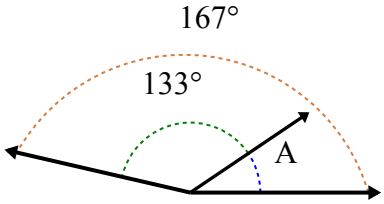

11)

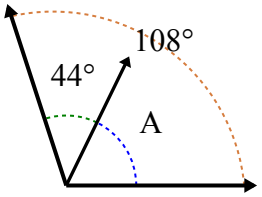

12)

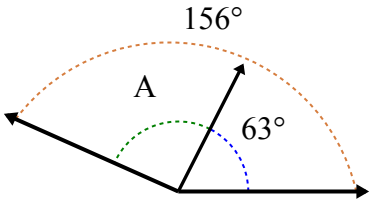

Ответы

1. _____
2. _____
3. _____
4. _____
5. _____
6. _____
7. _____
8. _____
9. _____
10. _____
11. _____
12. _____

1-10	92	83	75	67	58	50	42	33	25	17
11-12	8	0								

Определите значение угла 'A'.

1)

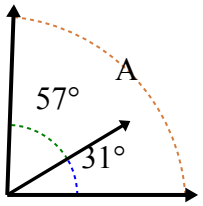

2)

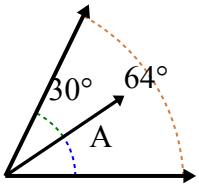

3)

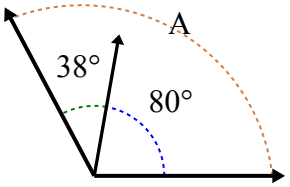

4)

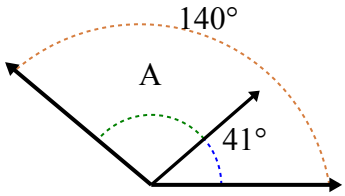

5)

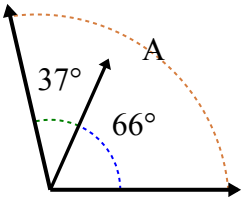

6)

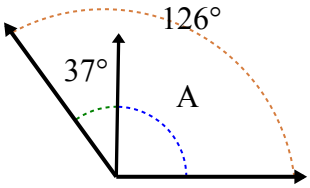

7)

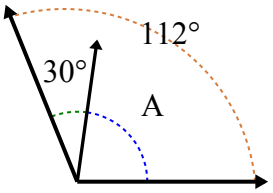

8)

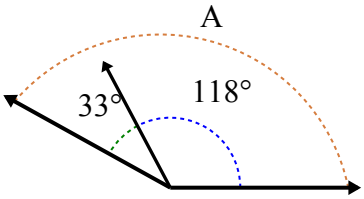

9)

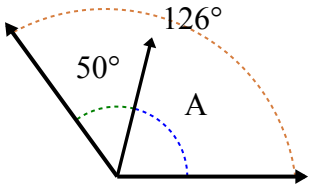

10)

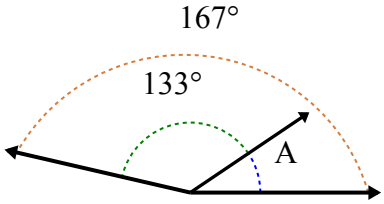

11)

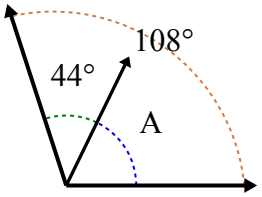

12)

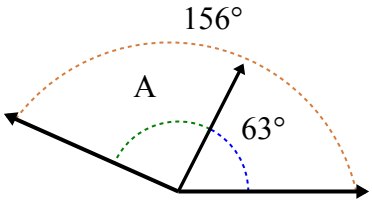

Ответы

1. 88
2. 34
3. 118
4. 99
5. 103
6. 89
7. 82
8. 151
9. 76
10. 34
11. 64
12. 93

1-10	92	83	75	67	58	50	42	33	25	17
11-12	8	0								

Определение неизвестного угла Имя:

Определите значение угла 'A'.

1)

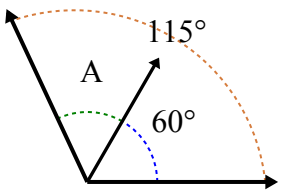

2)

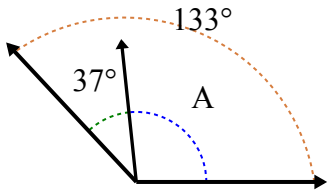

3)

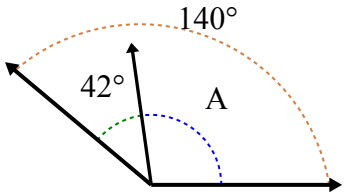

4)

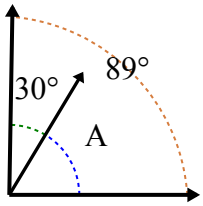

5)

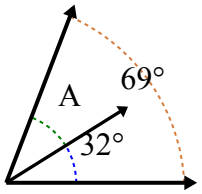

6)

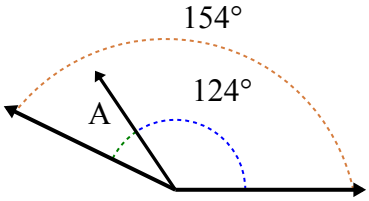

7)

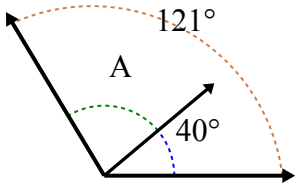

8)

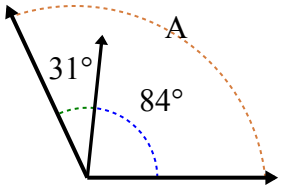

9)

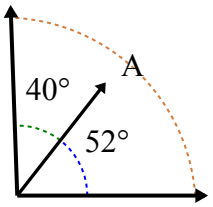

10)

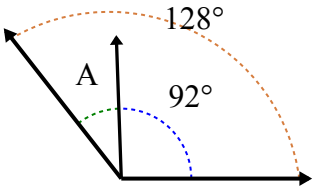

11)

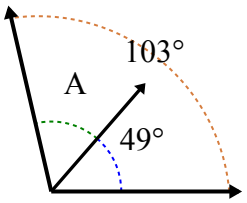

12)

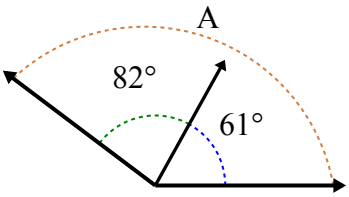

Ответы

1. _____
2. _____
3. _____
4. _____
5. _____
6. _____
7. _____
8. _____
9. _____
10. _____
11. _____
12. _____

1-10	92	83	75	67	58	50	42	33	25	17
11-12	8	0								

Определение неизвестного угла Имя: Ключ к правильным ответам

Определите значение угла 'A'.

1)

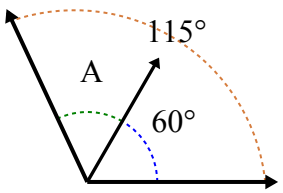

2)

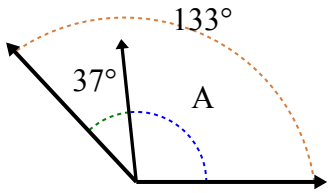

3)

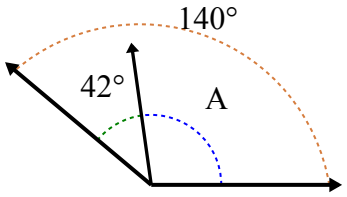

4)

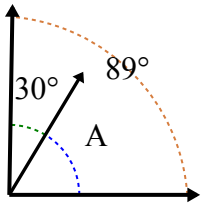

5)

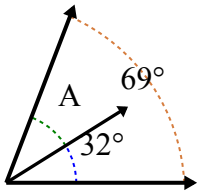

6)

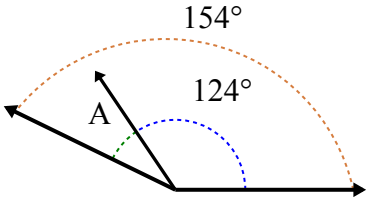

7)

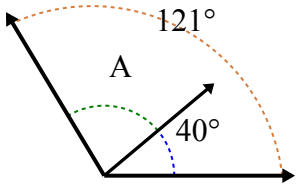

8)

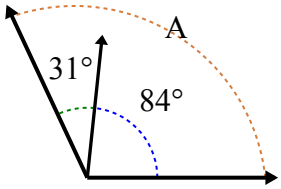

9)

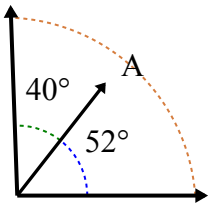

10)

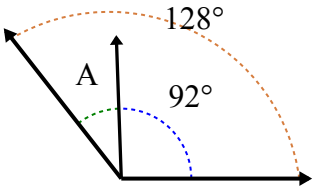

11)

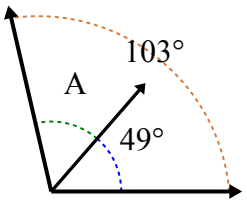

12)

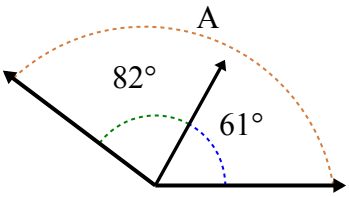

Ответы

1. 55
2. 96
3. 98
4. 59
5. 37
6. 30
7. 81
8. 115
9. 92
10. 36
11. 54
12. 143

1-10	92	83	75	67	58	50	42	33	25	17
11-12	8	0								

Определение неизвестного угла Имя:

Определите значение угла 'A'.

1)

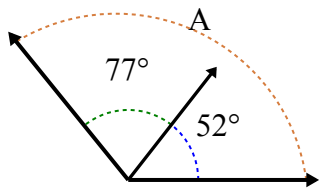

2)

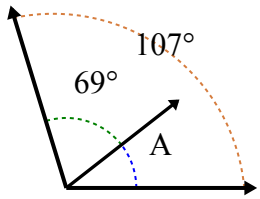

3)

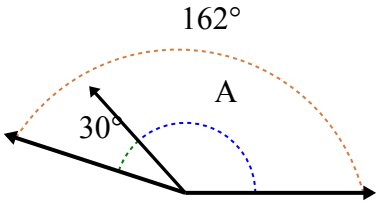

4)

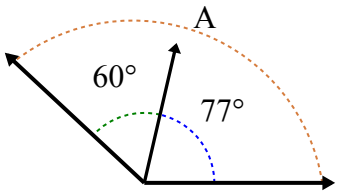

5)

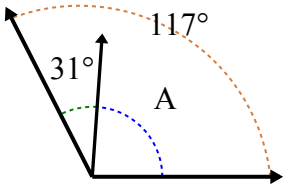

6)

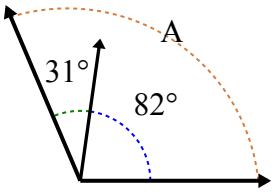

7)

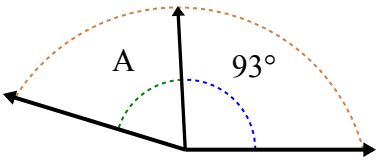

8)

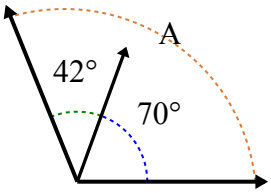

9)

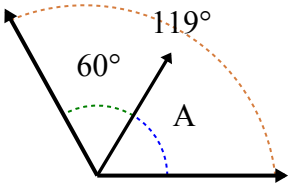

10)

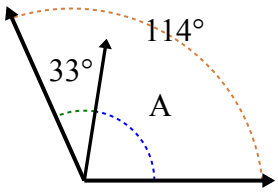

11)

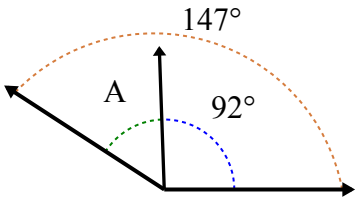

12)

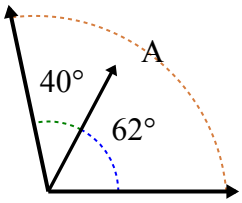

Ответы

1. _____
2. _____
3. _____
4. _____
5. _____
6. _____
7. _____
8. _____
9. _____
10. _____
11. _____
12. _____

1-10	92	83	75	67	58	50	42	33	25	17
11-12	8	0								

Определите значение угла 'A'.

1)

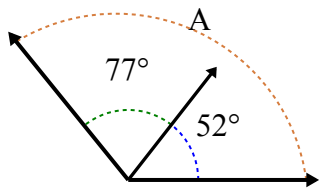

2)

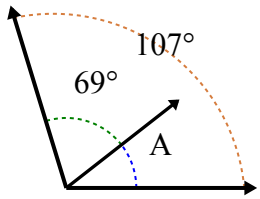

3)

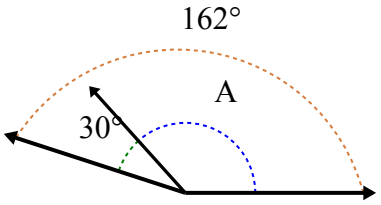

4)

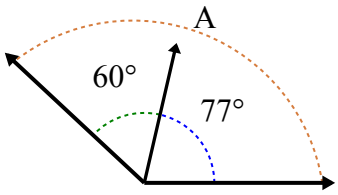

5)

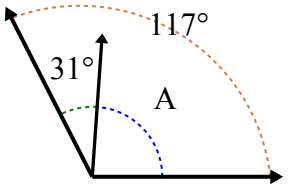

6)

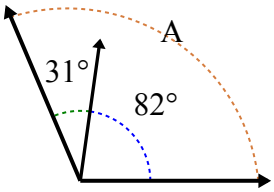

7)

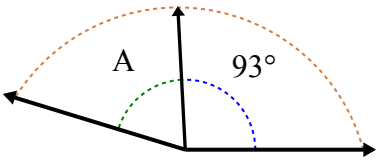

8)

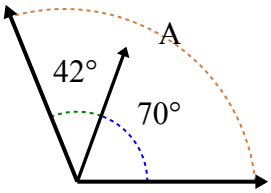

9)

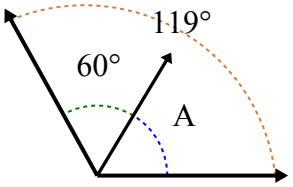

10)

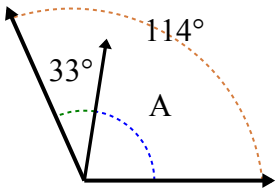

11)

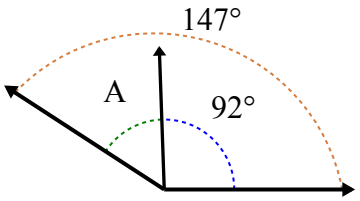

12)

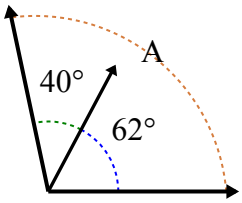

Ответы

1. **129**
2. **38**
3. **132**
4. **137**
5. **86**
6. **113**
7. **70**
8. **112**
9. **59**
10. **81**
11. **55**
12. **102**

1-10	92	83	75	67	58	50	42	33	25	17
11-12	8	0								

Определение неизвестного угла Имя:

Определите значение угла 'A'.

1)

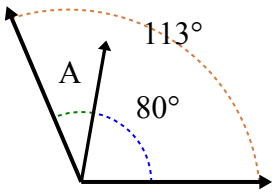

2)

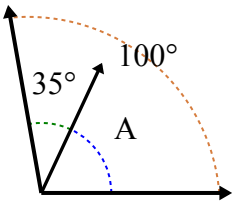

3)

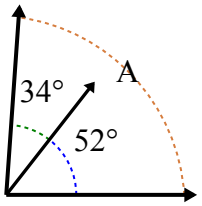

4)

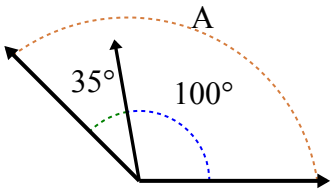

5)

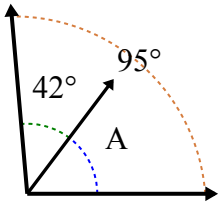

6)

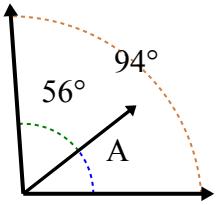

7)

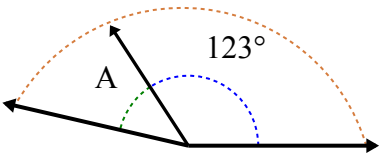

8)

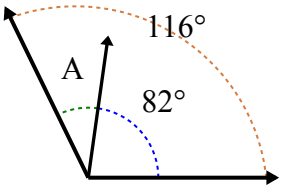

9)

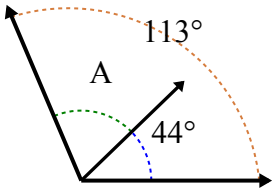

10)

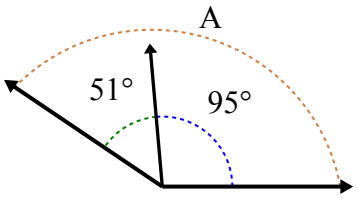

11)

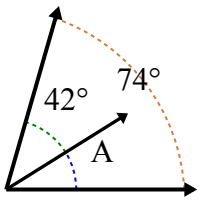

12)

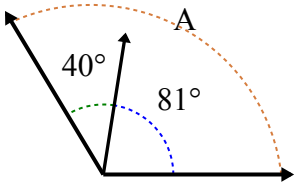

Ответы

1. _____
2. _____
3. _____
4. _____
5. _____
6. _____
7. _____
8. _____
9. _____
10. _____
11. _____
12. _____

1-10	92	83	75	67	58	50	42	33	25	17
11-12	8	0								

Определение неизвестного угла Имя: Ключ к правильным ответам

Определите значение угла 'A'.

1)

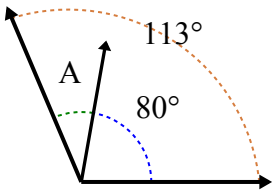

2)

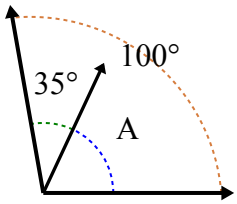

3)

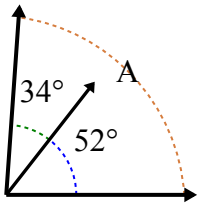

4)

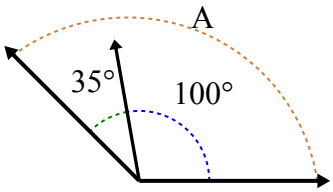

5)

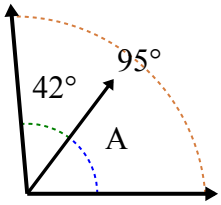

6)

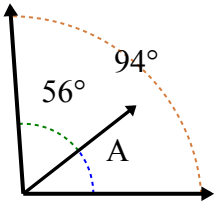

7)

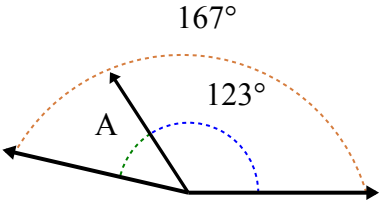

8)

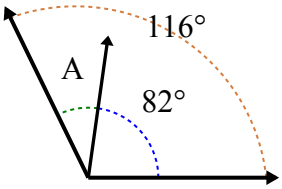

9)

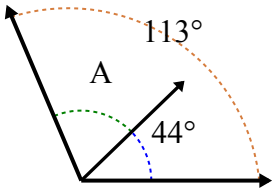

10)

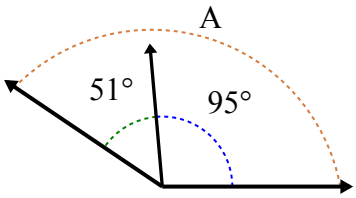

11)

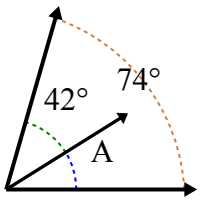

12)

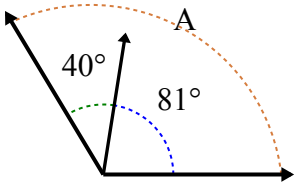

Ответы

1. 33
2. 65
3. 86
4. 135
5. 53
6. 38
7. 44
8. 34
9. 69
10. 146
11. 32
12. 121

1-10	92	83	75	67	58	50	42	33	25	17
11-12	8	0								