Заполнение и согласование уравнений объема Имя:

Сопоставьте каждую проблему с уравнением, которое могло бы ее представить. Ответьте с пропущенным термином и буквой.

об) 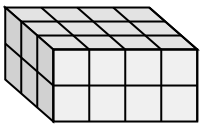

1) 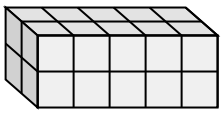

2) 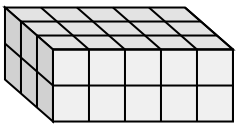

3) 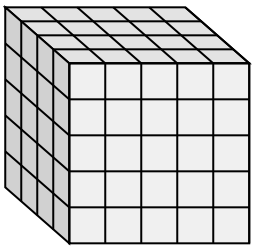

4) 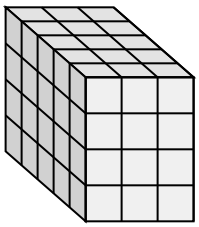

5) 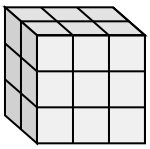

6) 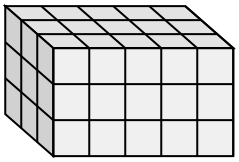

7) 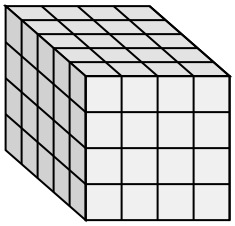

8) 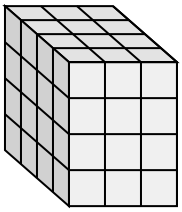

9) 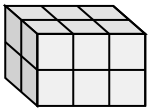

10) 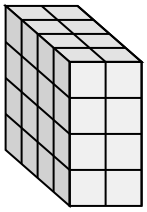

11) 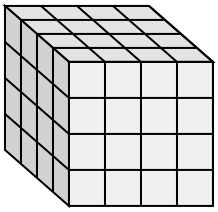

A. 4 × 3 × 4 = ___

B. ___ × 5 × 5 = 100

C. ___ × 3 × 2 = 12

D. ___ × 4 × 4 = 80

E. 5 × ___ × 4 = 60

F. ___ × 5 × 2 = 20

G. 4 × 4 × ___ = 64

H. 3 × ___ × 2 = 30

I. ___ × 2 × 4 = 32

J. 3 × 4 × 2 = ___

K. 3 × 5 × ___ = 45

L. 2 × 3 × ___ = 18

Ответы

об. J , 24

1. _____

2. _____

3. _____

4. _____

5. _____

6. _____

7. _____

8. _____

9. _____

10. _____

11. _____

1-10	91	82	73	64	55	45	36	27	18	9
11	0									

Заполнение и согласование уравнений объема Имя: Ключ к правильным ответам

Сопоставьте каждую проблему с уравнением, которое могло бы ее представить. Ответьте с пропущенным термином и буквой.

об) 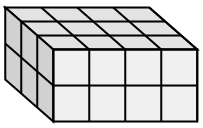

1) 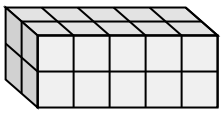

2) 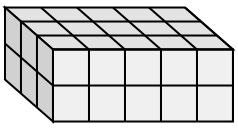

3) 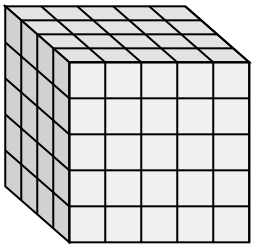

4) 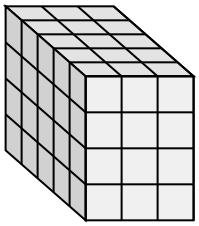

5) 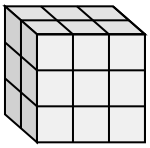

6) 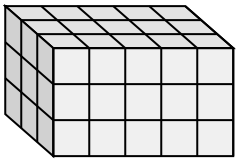

7) 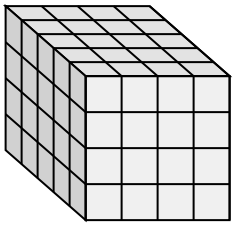

8) 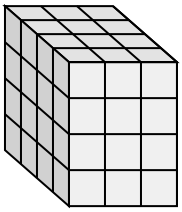

9) 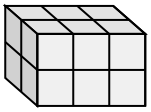

10) 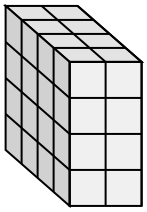

11) 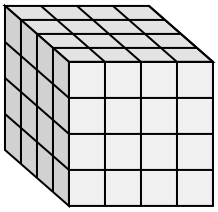

A. $4 \times 3 \times 4 =$ ___

B. ___ $\times 5 \times 5 = 100$

C. ___ $\times 3 \times 2 = 12$

D. ___ $\times 4 \times 4 = 80$

E. $5 \times$ ___ $\times 4 = 60$

F. ___ $\times 5 \times 2 = 20$

G. $4 \times 4 \times$ ___ $= 64$

H. $3 \times$ ___ $\times 2 = 30$

I. ___ $\times 2 \times 4 = 32$

J. $3 \times 4 \times 2 =$ ___

K. $3 \times 5 \times$ ___ $= 45$

L. $2 \times 3 \times$ ___ $= 18$

Ответы

об. J , 24

1. F , 2

2. H , 5

3. B , 4

4. E , 3

5. L , 3

6. K , 3

7. D , 5

8. A , 48

9. C , 2

10. I , 4

11. G , 4

1-10	91	82	73	64	55	45	36	27	18	9
11	0									