Заполнение и согласование уравнений объема Имя:

Сопоставьте каждую проблему с уравнением, которое могло бы ее представить. Ответьте с пропущенным термином и буквой.

об) 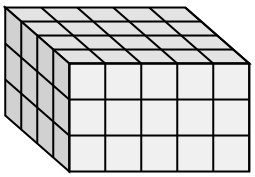

1) 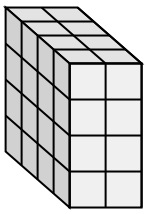

2) 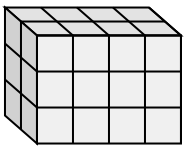

3) 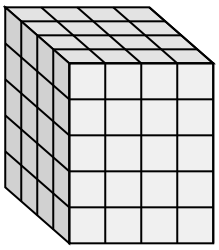

4) 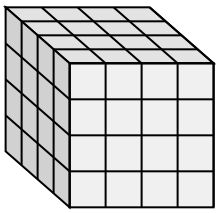

5) 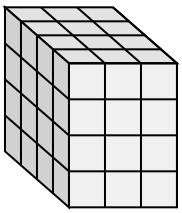

6) 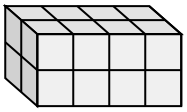

7) 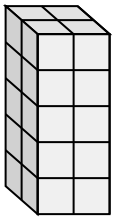

8) 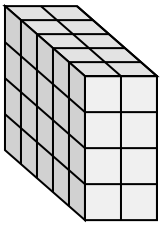

9) 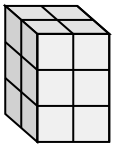

10) 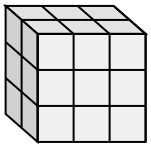

11) 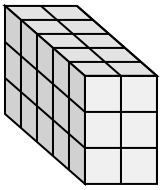

A. 2 × 2 × 3 = ___

B. ___ × 2 × 4 = 40

C. 2 × 3 × ___ = 18

D. 2 × 4 × ___ = 24

E. 4 × 5 × 3 = ___

F. 2 × 2 × 5 = ___

G. 4 × ___ × 4 = 64

H. ___ × 4 × 2 = 16

I. 4 × 4 × ___ = 80

J. ___ × 3 × 4 = 48

K. 4 × 2 × 4 = ___

L. 5 × ___ × 3 = 30

Ответы

об. E , 60

1. ___

2. ___

3. ___

4. ___

5. ___

6. ___

7. ___

8. ___

9. ___

10. ___

11. ___

1-10	91	82	73	64	55	45	36	27	18	9
11	0									

Заполнение и согласование уравнений объема Имя: Ключ к правильным ответам

Сопоставьте каждую проблему с уравнением, которое могло бы ее представить. Ответьте с пропущенным термином и буквой.

об) 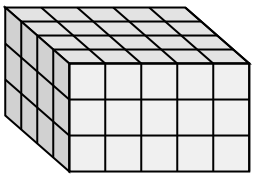

1) 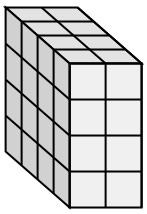

2) 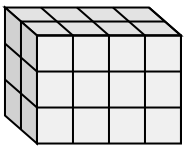

3) 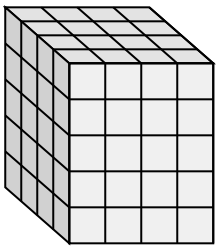

4) 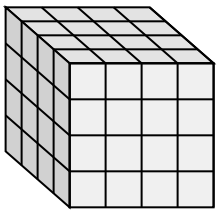

5) 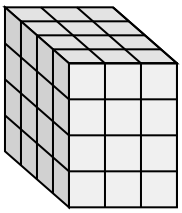

6) 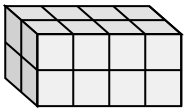

7) 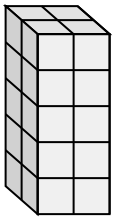

8) 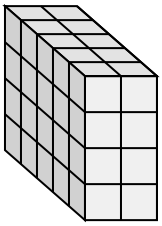

9) 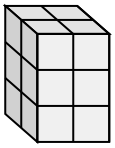

10) 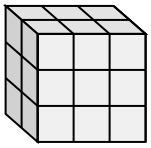

11) 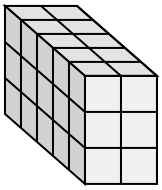

A. 2 × 2 × 3 = ___

B. ___ × 2 × 4 = 40

C. 2 × 3 × ___ = 18

D. 2 × 4 × ___ = 24

E. 4 × 5 × 3 = ___

F. 2 × 2 × 5 = ___

G. 4 × ___ × 4 = 64

H. ___ × 4 × 2 = 16

I. 4 × 4 × ___ = 80

J. ___ × 3 × 4 = 48

K. 4 × 2 × 4 = ___

L. 5 × ___ × 3 = 30

Ответы

об. E , 60

1. K , 32

2. D , 3

3. I , 5

4. G , 4

5. J , 4

6. H , 2

7. F , 20

8. B , 5

9. A , 12

10. C , 3

11. L , 2

1-10	91	82	73	64	55	45	36	27	18	9
11	0									