Определение малых единиц Имя:

**Определите количество малых единиц в задачах.**

**об)** $6\frac{2}{3}$

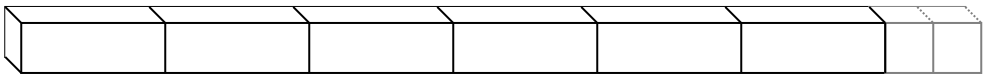

**1)** $8\frac{1}{5}$

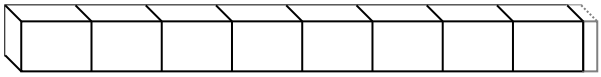

**2)** $5\frac{2}{3}$

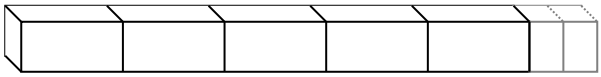

**3)** $8\frac{2}{3}$

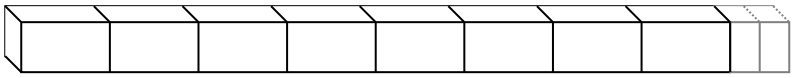

**4)** $5\frac{1}{2}$

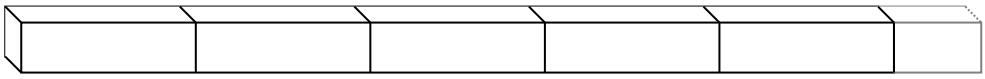

**5)** $8\frac{2}{3}$

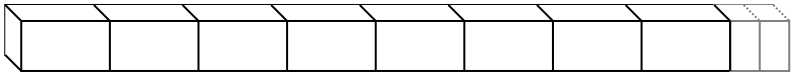

**6)** $5\frac{2}{4}$

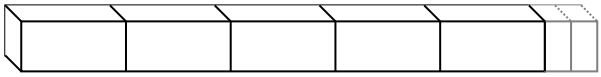

**7)** $6\frac{2}{4}$

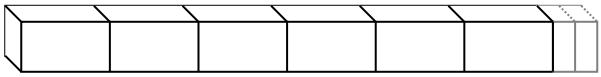

**8)** $3\frac{1}{4}$



**9)** $4\frac{3}{5}$

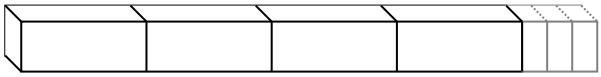

**10)** $1\frac{3}{5}$



## Ответы

об. 20

1. _____

2. _____

3. _____

4. _____

5. _____

6. _____

7. _____

8. _____

9. _____

10. _____



| 1-10 | 90 | 80 | 70 | 60 | 50 | 40 | 30 | 20 | 10 | 0 |
|---|---|---|---|---|---|---|---|---|---|---|

Определение малых единиц

Имя: Ключ к правильным ответам

**Определите количество малых единиц в задачах.**

об) $6\frac{2}{3}$

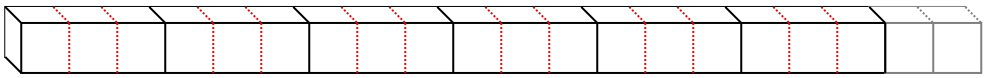

1) $8\frac{1}{5}$

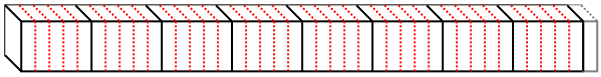

2) $5\frac{2}{3}$

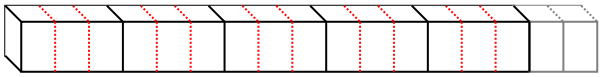

3) $8\frac{2}{3}$

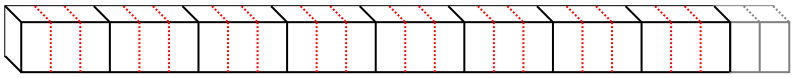

4) $5\frac{1}{2}$

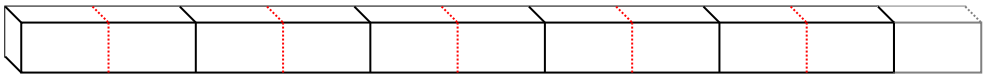

5) $8\frac{2}{3}$

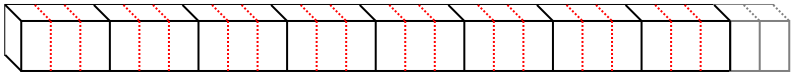

6) $5\frac{2}{4}$

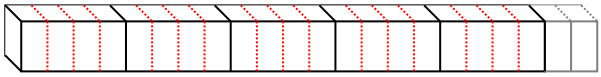

7) $6\frac{2}{4}$

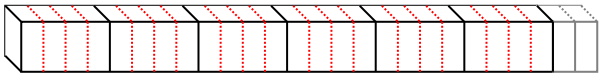

8) $3\frac{1}{4}$

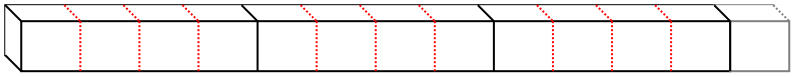

9) $4\frac{3}{5}$

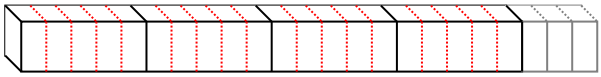

10) $1\frac{3}{5}$

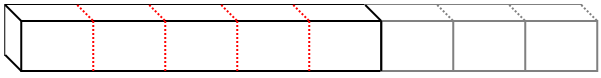

## Ответы

| | |
|---|---|
| об. | 20 |
| 1. | 41 |
| 2. | 17 |
| 3. | 26 |
| 4. | 11 |
| 5. | 26 |
| 6. | 22 |
| 7. | 26 |
| 8. | 13 |
| 9. | 23 |
| 10. | 8 |



| 1-10 | 90 | 80 | 70 | 60 | 50 | 40 | 30 | 20 | 10 | 0 |
|---|---|---|---|---|---|---|---|---|---|---|

**Определите количество малых единиц в задачах.**

**об)** $4\frac{1}{2}$



**1)** $9\frac{1}{3}$

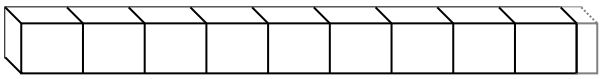

**2)** $3\frac{1}{2}$



**3)** $1\frac{1}{2}$



**4)** $2\frac{1}{3}$

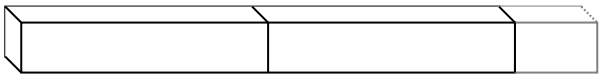

**5)** $6\frac{1}{2}$

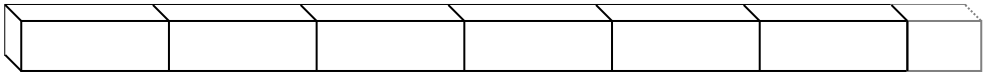

**6)** $3\frac{2}{4}$



**7)** $1\frac{3}{5}$



**8)** $7\frac{3}{5}$

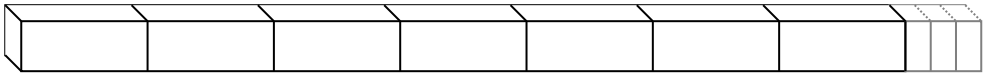

**9)** $6\frac{1}{4}$

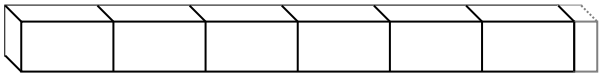

**10)** $3\frac{3}{4}$

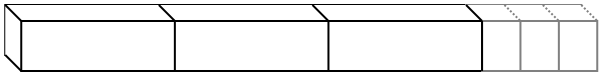

## Ответы

об. 9

1. _____
2. _____
3. _____
4. _____
5. _____
6. _____
7. _____
8. _____
9. _____
10. _____



| 1-10 | 90 | 80 | 70 | 60 | 50 | 40 | 30 | 20 | 10 | 0 |
|---|---|---|---|---|---|---|---|---|---|---|

**Определите количество малых единиц в задачах.**

об) $4\frac{1}{2}$



1) $9\frac{1}{3}$

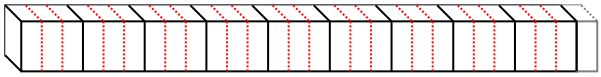

2) $3\frac{1}{2}$



3) $1\frac{1}{2}$



4) $2\frac{1}{3}$

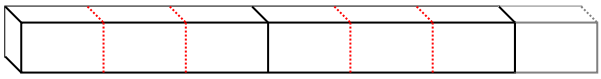

5) $6\frac{1}{2}$

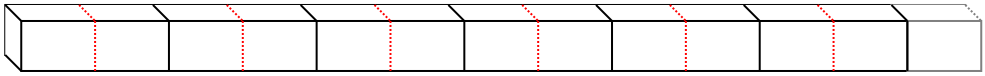

6) $3\frac{2}{4}$

7) $1\frac{3}{5}$

8) $7\frac{3}{5}$

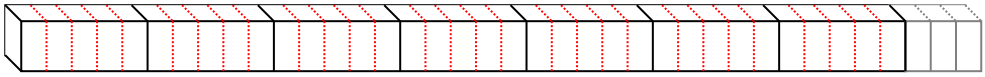

9) $6\frac{1}{4}$

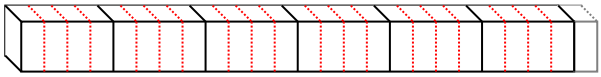

10) $3\frac{3}{4}$

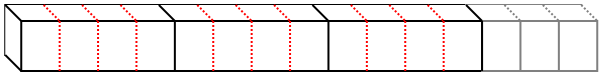

## Ответы

| | |
|---|---|
| об. | 9 |
| 1. | 28 |
| 2. | 7 |
| 3. | 3 |
| 4. | 7 |
| 5. | 13 |
| 6. | 14 |
| 7. | 8 |
| 8. | 38 |
| 9. | 25 |
| 10. | 15 |



| 1-10 | 90 | 80 | 70 | 60 | 50 | 40 | 30 | 20 | 10 | 0 |
|---|---|---|---|---|---|---|---|---|---|---|

Определение малых единиц Имя:

**Определите количество малых единиц в задачах.**

**об)** $1\frac{3}{5}$



**1)** $5\frac{1}{2}$



**2)** $2\frac{1}{2}$



**3)** $9\frac{1}{3}$

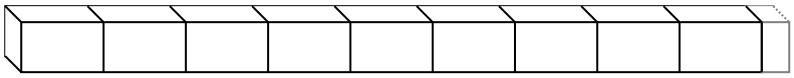

**4)** $2\frac{1}{5}$

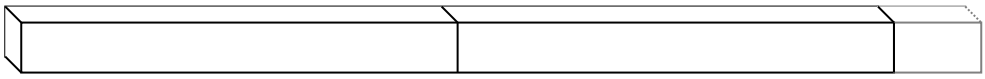

**5)** $6\frac{1}{2}$

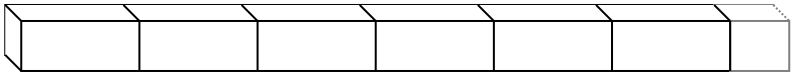

**6)** $8\frac{1}{2}$

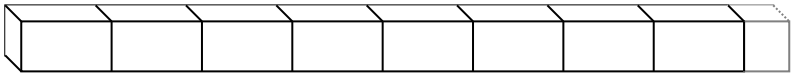

**7)** $8\frac{3}{4}$

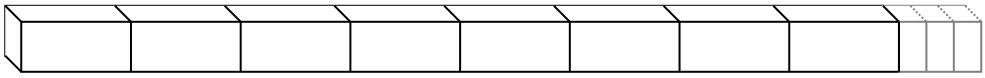

**8)** $3\frac{1}{2}$



**9)** $5\frac{1}{3}$



**10)** $5\frac{1}{5}$



## Ответы

об. 8

1. _____

2. _____

3. _____

4. _____

5. _____

6. _____

7. _____

8. _____

9. _____

10. _____



| 1-10 | 90 | 80 | 70 | 60 | 50 | 40 | 30 | 20 | 10 | 0 |
|---|---|---|---|---|---|---|---|---|---|---|

Определение малых единиц

Имя: **Ключ к правильным ответам**

**Определите количество малых единиц в задачах.**

**об)** $1\frac{3}{5}$

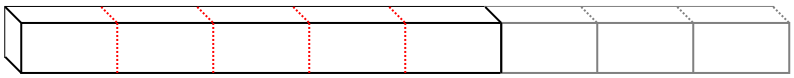

**1)** $5\frac{1}{2}$

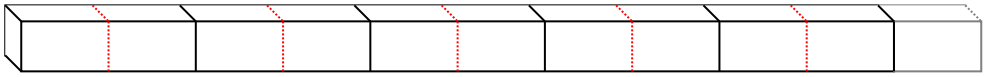

**2)** $2\frac{1}{2}$



**3)** $9\frac{1}{3}$

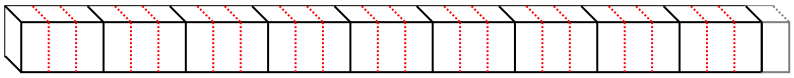

**4)** $2\frac{1}{5}$

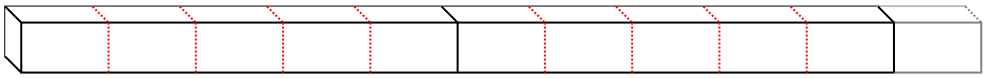

**5)** $6\frac{1}{2}$

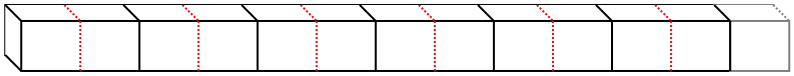

**6)** $8\frac{1}{2}$

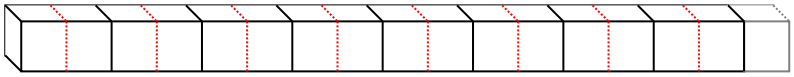

**7)** $8\frac{3}{4}$

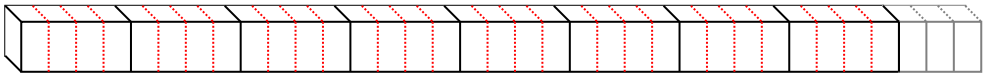

**8)** $3\frac{1}{2}$



**9)** $5\frac{1}{3}$

**10)** $5\frac{1}{5}$

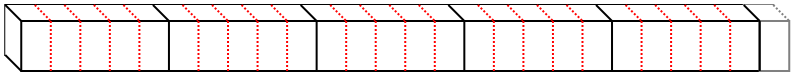

## Ответы

| | |
|---|---|
| об. | 8 |
| 1. | 11 |
| 2. | 5 |
| 3. | 28 |
| 4. | 11 |
| 5. | 13 |
| 6. | 17 |
| 7. | 35 |
| 8. | 7 |
| 9. | 16 |
| 10. | 26 |



| 1-10 | 90 | 80 | 70 | 60 | 50 | 40 | 30 | 20 | 10 | 0 |
|---|---|---|---|---|---|---|---|---|---|---|

**Определите количество малых единиц в задачах.**

**об)** $7\frac{1}{3}$

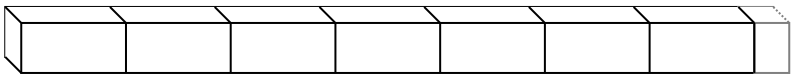

**1)** $8\frac{2}{3}$

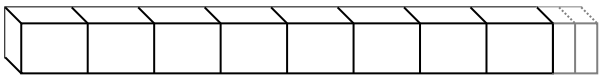

**2)** $3\frac{1}{3}$



**3)** $4\frac{1}{2}$

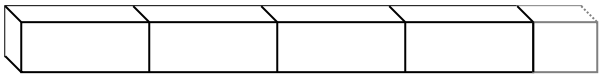

**4)** $9\frac{3}{4}$

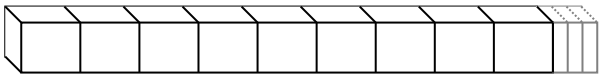

**5)** $4\frac{1}{2}$



**6)** $8\frac{2}{4}$

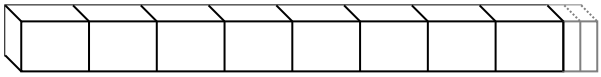

**7)** $7\frac{2}{3}$

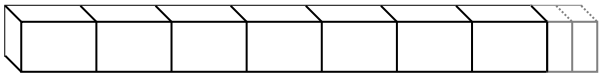

**8)** $4\frac{3}{4}$



**9)** $1\frac{1}{3}$



**10)** $8\frac{1}{3}$

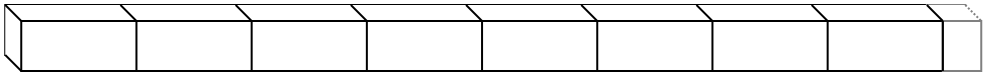

## Ответы

об. 22

1. _____
2. _____
3. _____
4. _____
5. _____
6. _____
7. _____
8. _____
9. _____
10. _____



| 1-10 | 90 | 80 | 70 | 60 | 50 | 40 | 30 | 20 | 10 | 0 |
|---|---|---|---|---|---|---|---|---|---|---|

**Определите количество малых единиц в задачах.**

**об)** $7\frac{1}{3}$

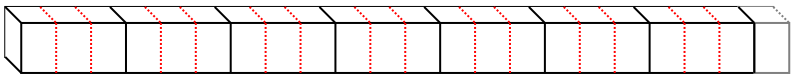

**1)** $8\frac{2}{3}$

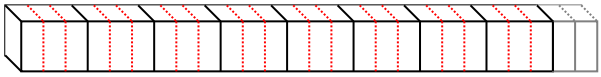

**2)** $3\frac{1}{3}$

**3)** $4\frac{1}{2}$

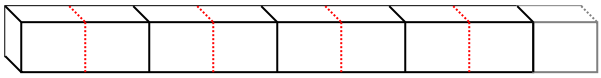

**4)** $9\frac{3}{4}$

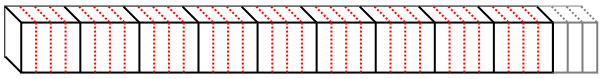

**5)** $4\frac{1}{2}$



**6)** $8\frac{2}{4}$

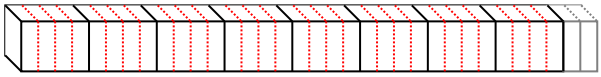

**7)** $7\frac{2}{3}$

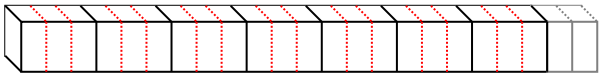

**8)** $4\frac{3}{4}$

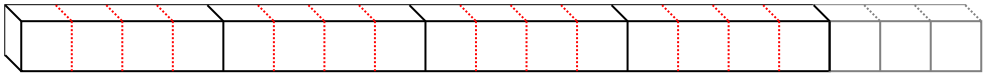

**9)** $1\frac{1}{3}$

**10)** $8\frac{1}{3}$

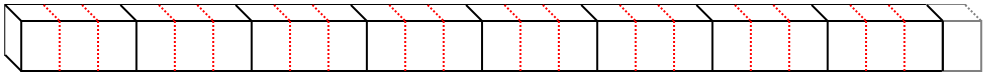

## Ответы

| | |
|---|---|
| об. | 22 |
| 1. | 26 |
| 2. | 10 |
| 3. | 9 |
| 4. | 39 |
| 5. | 9 |
| 6. | 34 |
| 7. | 23 |
| 8. | 19 |
| 9. | 4 |
| 10. | 25 |



| 1-10 | 90 | 80 | 70 | 60 | 50 | 40 | 30 | 20 | 10 | 0 |
|---|---|---|---|---|---|---|---|---|---|---|

**Определите количество малых единиц в задачах.**

**об)** $9\frac{1}{2}$

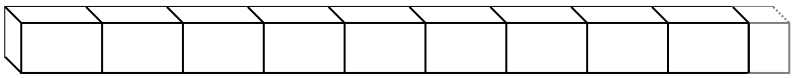

**1)** $9\frac{1}{2}$

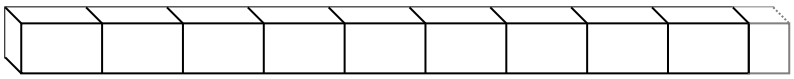

**2)** $3\frac{2}{3}$

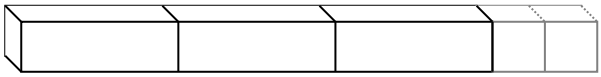

**3)** $9\frac{2}{3}$

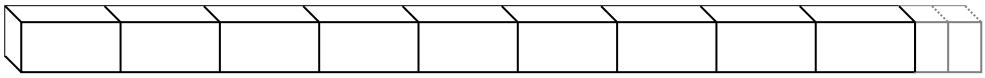

**4)** $7\frac{2}{4}$

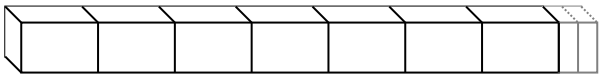

**5)** $2\frac{1}{2}$



**6)** $5\frac{2}{4}$

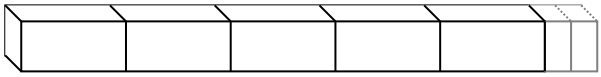

**7)** $4\frac{2}{4}$

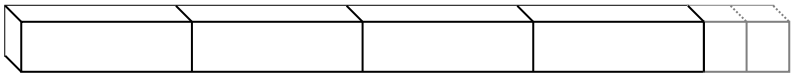

**8)** $4\frac{2}{3}$



**9)** $4\frac{1}{5}$

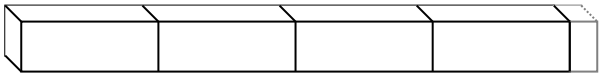

**10)** $8\frac{2}{3}$

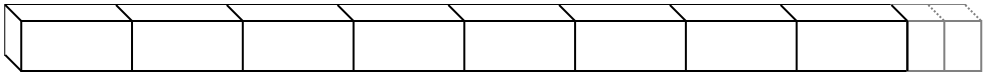

**Ответы**

об. 19

1. _____

2. _____

3. _____

4. _____

5. _____

6. _____

7. _____

8. _____

9. _____

10. _____



| 1-10 | 90 | 80 | 70 | 60 | 50 | 40 | 30 | 20 | 10 | 0 |
|---|---|---|---|---|---|---|---|---|---|---|

**Определите количество малых единиц в задачах.**

**об)** $9\frac{1}{2}$

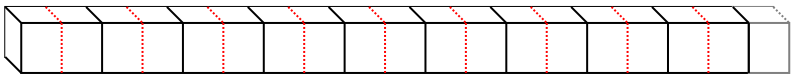

**1)** $9\frac{1}{2}$

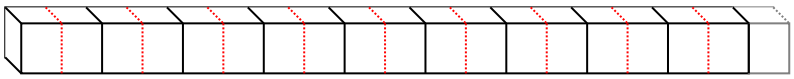

**2)** $3\frac{2}{3}$

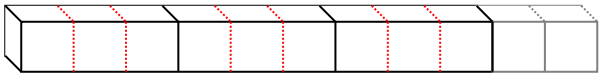

**3)** $9\frac{2}{3}$

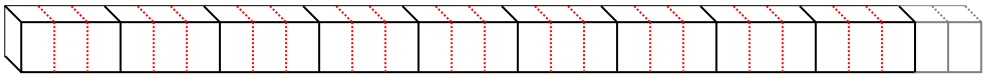

**4)** $7\frac{2}{4}$

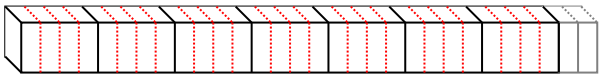

**5)** $2\frac{1}{2}$



**6)** $5\frac{2}{4}$

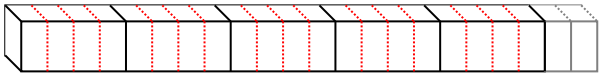

**7)** $4\frac{2}{4}$

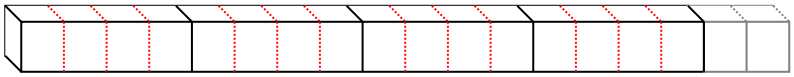

**8)** $4\frac{2}{3}$

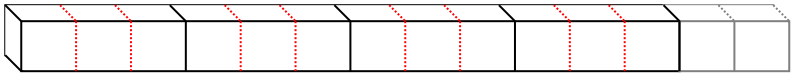

**9)** $4\frac{1}{5}$

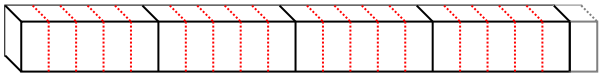

**10)** $8\frac{2}{3}$

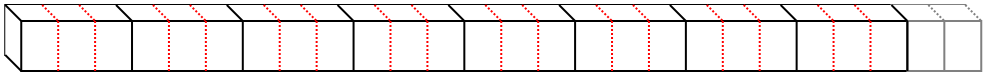

## Ответы

| | |
|---|---|
| об. | 19 |
| 1. | 19 |
| 2. | 11 |
| 3. | 29 |
| 4. | 30 |
| 5. | 5 |
| 6. | 22 |
| 7. | 18 |
| 8. | 14 |
| 9. | 21 |
| 10. | 26 |



| 1-10 | 90 | 80 | 70 | 60 | 50 | 40 | 30 | 20 | 10 | 0 |
|---|---|---|---|---|---|---|---|---|---|---|

**Определите количество малых единиц в задачах.**

об) $8\frac{1}{4}$

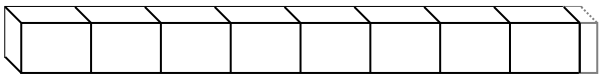

1) $6\frac{1}{4}$

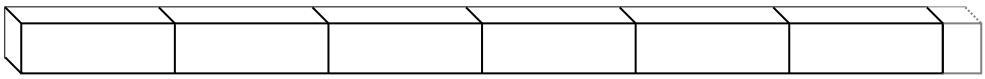

2) $6\frac{1}{2}$

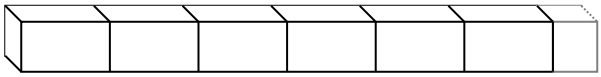

3) $7\frac{1}{4}$

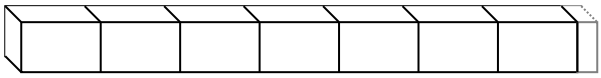

4) $3\frac{3}{5}$

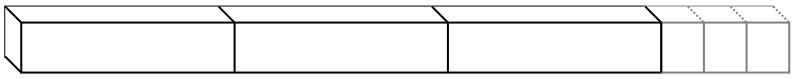

5) $3\frac{1}{3}$



6) $2\frac{2}{5}$

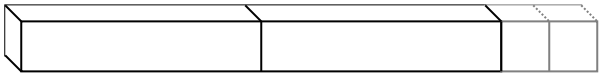

7) $9\frac{1}{3}$

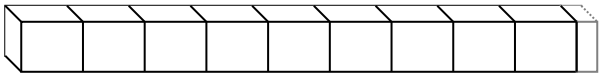

8) $3\frac{3}{5}$

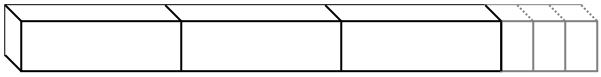

9) $2\frac{1}{5}$

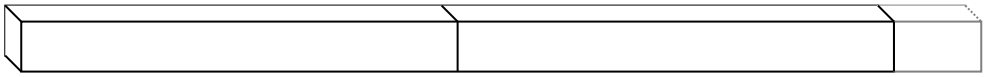

10) $9\frac{1}{2}$

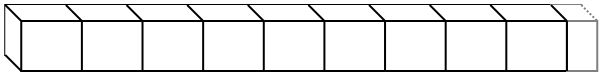

**Ответы**

об. 33

1. _____

2. _____

3. _____

4. _____

5. _____

6. _____

7. _____

8. _____

9. _____

10. _____



| 1-10 | 90 | 80 | 70 | 60 | 50 | 40 | 30 | 20 | 10 | 0 |
|---|---|---|---|---|---|---|---|---|---|---|

Определение малых единиц

Имя: Ключ к правильным ответам

**Определите количество малых единиц в задачах.**

**об)** $8\frac{1}{4}$

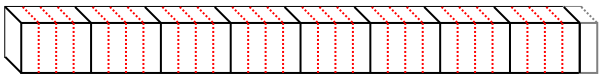

**1)** $6\frac{1}{4}$

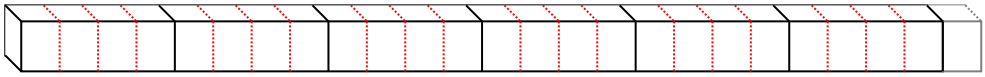

**2)** $6\frac{1}{2}$

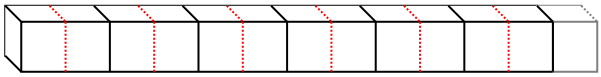

**3)** $7\frac{1}{4}$

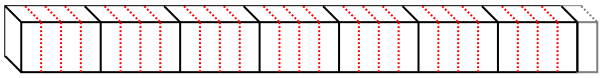

**4)** $3\frac{3}{5}$

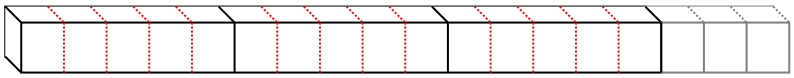

**5)** $3\frac{1}{3}$

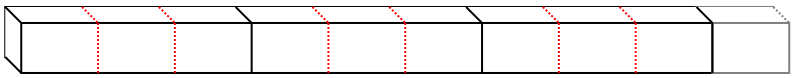

**6)** $2\frac{2}{5}$

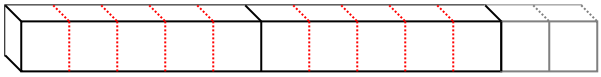

**7)** $9\frac{1}{3}$

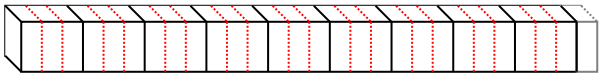

**8)** $3\frac{3}{5}$

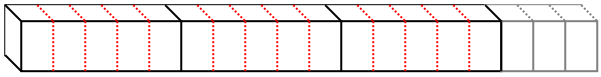

**9)** $2\frac{1}{5}$

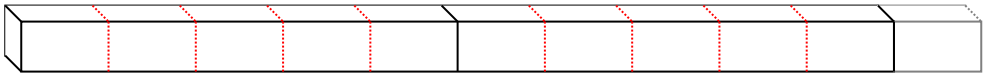

**10)** $9\frac{1}{2}$

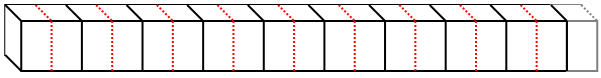

## Ответы

| | |
|---|---|
| об. | 33 |
| 1. | 25 |
| 2. | 13 |
| 3. | 29 |
| 4. | 18 |
| 5. | 10 |
| 6. | 12 |
| 7. | 28 |
| 8. | 18 |
| 9. | 11 |
| 10. | 19 |



| 1-10 | 90 | 80 | 70 | 60 | 50 | 40 | 30 | 20 | 10 | 0 |
|---|---|---|---|---|---|---|---|---|---|---|

Определение малых единиц Имя:

**Определите количество малых единиц в задачах.**

**об)** $6\frac{3}{4}$

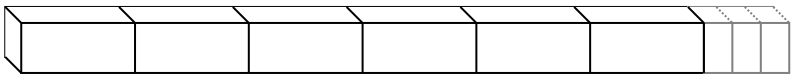

**1)** $7\frac{1}{2}$

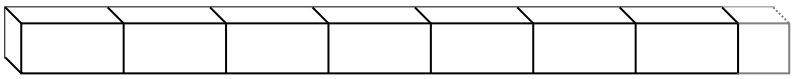

**2)** $5\frac{1}{2}$



**3)** $4\frac{1}{3}$

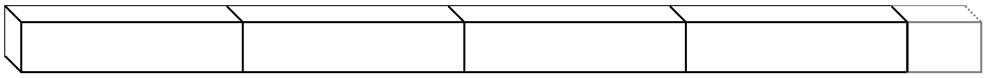

**4)** $9\frac{3}{4}$

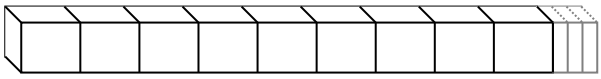

**5)** $7\frac{1}{2}$

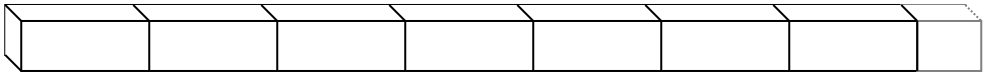

**6)** $8\frac{2}{3}$

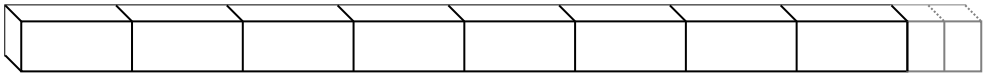

**7)** $2\frac{1}{2}$



**8)** $7\frac{1}{2}$

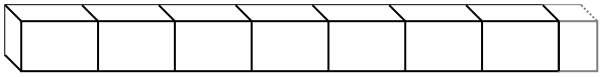

**9)** $2\frac{1}{3}$



**10)** $8\frac{1}{3}$

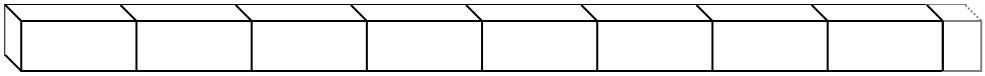

## Ответы

об. 27

1. _____

2. _____

3. _____

4. _____

5. _____

6. _____

7. _____

8. _____

9. _____

10. _____



| 1-10 | 90 | 80 | 70 | 60 | 50 | 40 | 30 | 20 | 10 | 0 |
|---|---|---|---|---|---|---|---|---|---|---|

**Определите количество малых единиц в задачах.**

об) $6\frac{3}{4}$

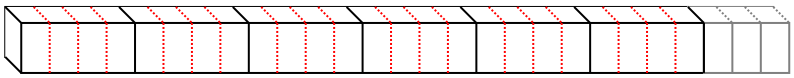

1) $7\frac{1}{2}$

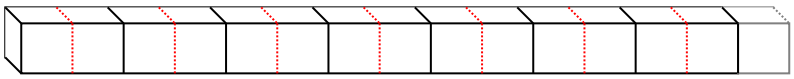

2) $5\frac{1}{2}$

3) $4\frac{1}{3}$

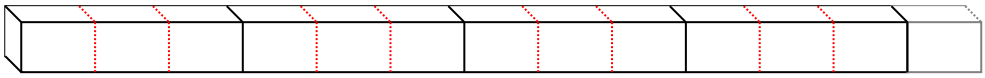

4) $9\frac{3}{4}$

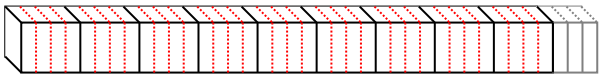

5) $7\frac{1}{2}$

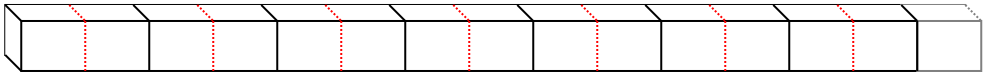

6) $8\frac{2}{3}$

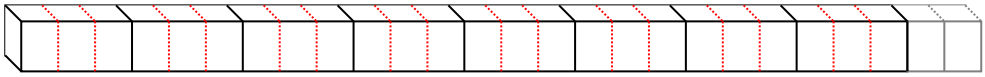

7) $2\frac{1}{2}$



8) $7\frac{1}{2}$

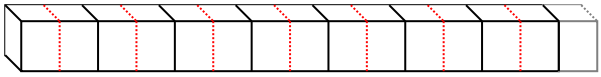

9) $2\frac{1}{3}$



10) $8\frac{1}{3}$

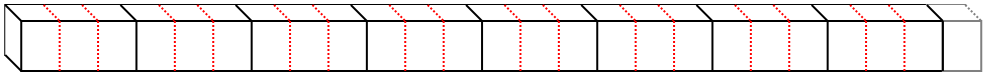

## Ответы

| | |
|---|---|
| об. | 27 |
| 1. | 15 |
| 2. | 11 |
| 3. | 13 |
| 4. | 39 |
| 5. | 15 |
| 6. | 26 |
| 7. | 5 |
| 8. | 15 |
| 9. | 7 |
| 10. | 25 |



| 1-10 | 90 | 80 | 70 | 60 | 50 | 40 | 30 | 20 | 10 | 0 |
|---|---|---|---|---|---|---|---|---|---|---|

**Определите количество малых единиц в задачах.**

об) $5\frac{2}{4}$

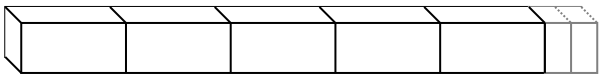

1) $6\frac{2}{4}$

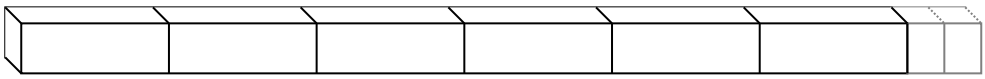

2) $2\frac{1}{5}$

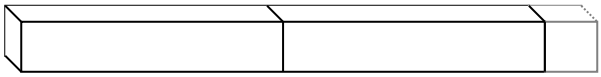

3) $2\frac{1}{3}$



4) $5\frac{1}{3}$



5) $6\frac{1}{5}$

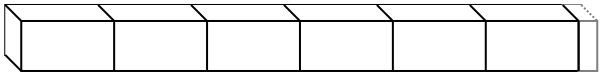

6) $3\frac{1}{5}$



7) $3\frac{1}{3}$



8) $1\frac{2}{5}$



9) $7\frac{2}{4}$

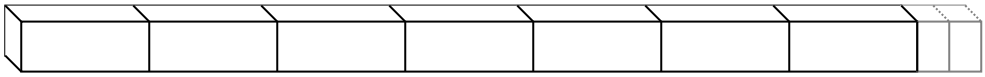

10) $3\frac{1}{4}$



**Ответы**

об. 22

1. _____
2. _____
3. _____
4. _____
5. _____
6. _____
7. _____
8. _____
9. _____
10. _____



| 1-10 | 90 | 80 | 70 | 60 | 50 | 40 | 30 | 20 | 10 | 0 |
|---|---|---|---|---|---|---|---|---|---|---|

**Определите количество малых единиц в задачах.**

об) $5\frac{2}{4}$

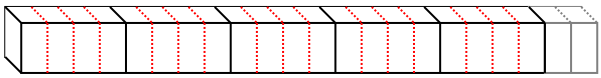

1) $6\frac{2}{4}$

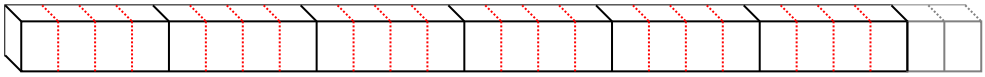

2) $2\frac{1}{5}$

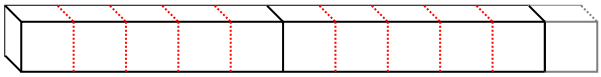

3) $2\frac{1}{3}$



4) $5\frac{1}{3}$

5) $6\frac{1}{5}$

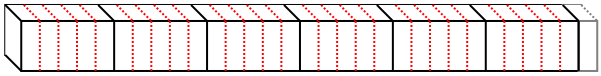

6) $3\frac{1}{5}$

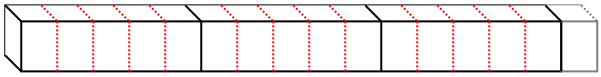

7) $3\frac{1}{3}$

8) $1\frac{2}{5}$

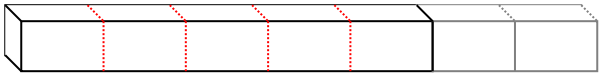

9) $7\frac{2}{4}$

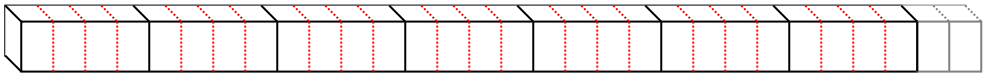

10) $3\frac{1}{4}$

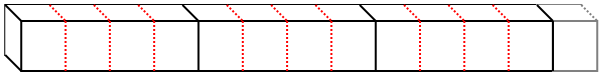

## Ответы

| | |
|---|---|
| об. | 22 |
| 1. | 26 |
| 2. | 11 |
| 3. | 7 |
| 4. | 16 |
| 5. | 31 |
| 6. | 16 |
| 7. | 10 |
| 8. | 7 |
| 9. | 30 |
| 10. | 13 |



| 1-10 | 90 | 80 | 70 | 60 | 50 | 40 | 30 | 20 | 10 | 0 |
|---|---|---|---|---|---|---|---|---|---|---|

Определение малых единиц Имя:

**Определите количество малых единиц в задачах.**

**об)** $8\frac{2}{3}$

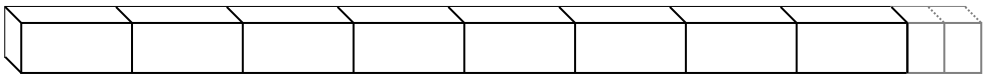

**1)** $7\frac{2}{3}$

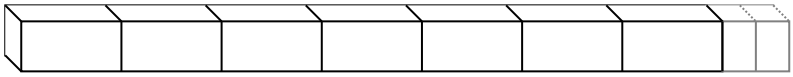

**2)** $5\frac{1}{3}$



**3)** $2\frac{1}{3}$

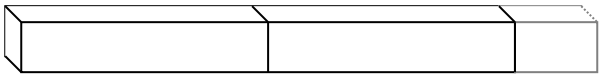

**4)** $1\frac{3}{4}$



**5)** $2\frac{2}{5}$



**6)** $7\frac{1}{2}$

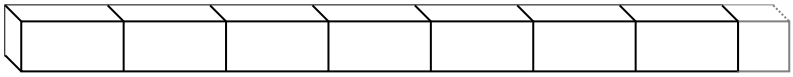

**7)** $9\frac{1}{4}$

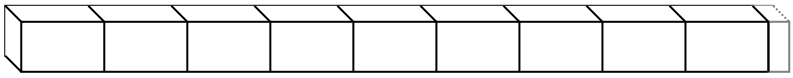

**8)** $1\frac{1}{2}$



**9)** $5\frac{2}{3}$

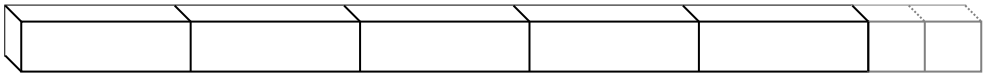

**10)** $2\frac{1}{3}$

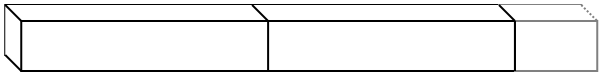

**Ответы**

об. 26

1. _____

2. _____

3. _____

4. _____

5. _____

6. _____

7. _____

8. _____

9. _____

10. _____



| 1-10 | 90 | 80 | 70 | 60 | 50 | 40 | 30 | 20 | 10 | 0 |
|---|---|---|---|---|---|---|---|---|---|---|

**Определите количество малых единиц в задачах.**

об) $8\frac{2}{3}$

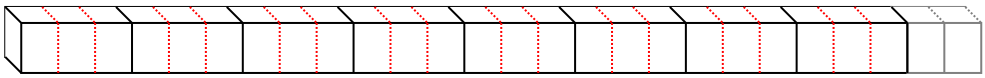

1) $7\frac{2}{3}$

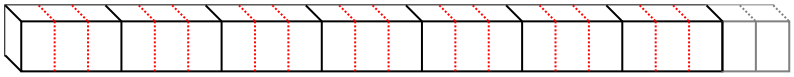

2) $5\frac{1}{3}$

3) $2\frac{1}{3}$

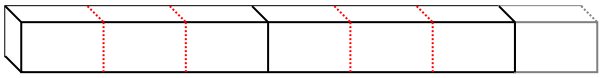

4) $1\frac{3}{4}$



5) $2\frac{2}{5}$

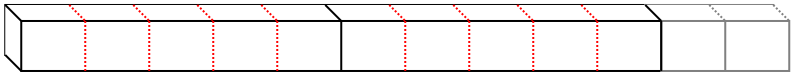

6) $7\frac{1}{2}$

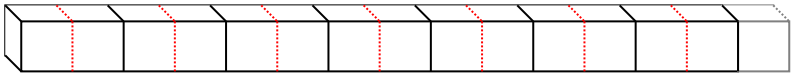

7) $9\frac{1}{4}$

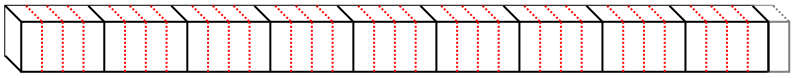

8) $1\frac{1}{2}$



9) $5\frac{2}{3}$

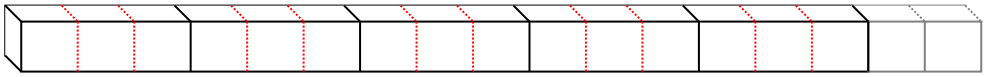

10) $2\frac{1}{3}$

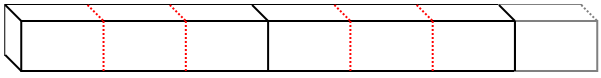

## Ответы

| | |
|---|---|
| об. | 26 |
| 1. | 23 |
| 2. | 16 |
| 3. | 7 |
| 4. | 7 |
| 5. | 12 |
| 6. | 15 |
| 7. | 37 |
| 8. | 3 |
| 9. | 17 |
| 10. | 7 |



| 1-10 | 90 | 80 | 70 | 60 | 50 | 40 | 30 | 20 | 10 | 0 |
|---|---|---|---|---|---|---|---|---|---|---|

Определение малых единиц Имя:

**Определите количество малых единиц в задачах.**

**об)** $5\frac{3}{4}$

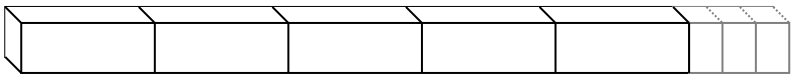

**1)** $9\frac{1}{5}$



**2)** $8\frac{4}{5}$

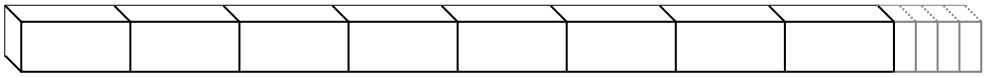

**3)** $4\frac{2}{5}$

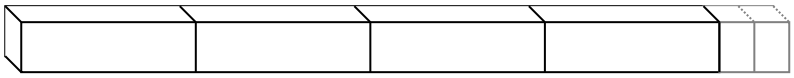

**4)** $7\frac{1}{3}$

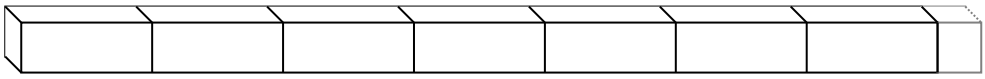

**5)** $8\frac{2}{3}$

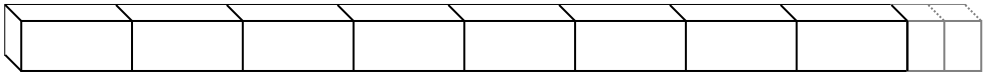

**6)** $2\frac{1}{3}$



**7)** $3\frac{2}{5}$



**8)** $9\frac{1}{5}$



**9)** $9\frac{3}{4}$

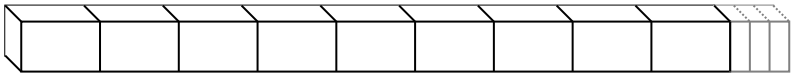

**10)** $1\frac{1}{2}$



## Ответы

об. 23

1. _____
2. _____
3. _____
4. _____
5. _____
6. _____
7. _____
8. _____
9. _____
10. _____



| 1-10 | 90 | 80 | 70 | 60 | 50 | 40 | 30 | 20 | 10 | 0 |
|---|---|---|---|---|---|---|---|---|---|---|

Определение малых единиц

Имя: Ключ к правильным ответам

**Определите количество малых единиц в задачах.**

**об)** $5\frac{3}{4}$

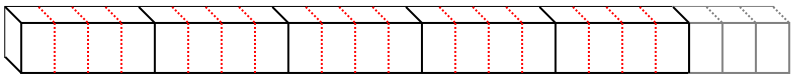

**1)** $9\frac{1}{5}$

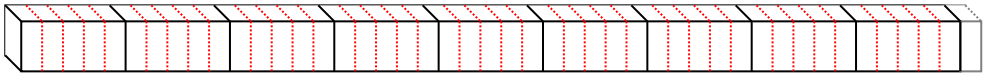

**2)** $8\frac{4}{5}$

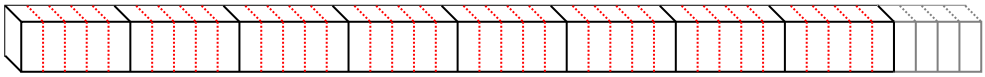

**3)** $4\frac{2}{5}$

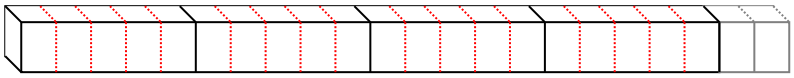

**4)** $7\frac{1}{3}$

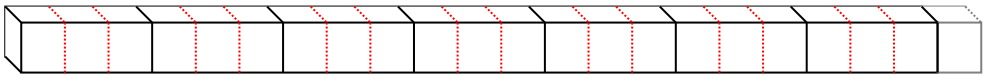

**5)** $8\frac{2}{3}$

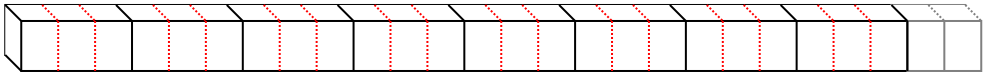

**6)** $2\frac{1}{3}$



**7)** $3\frac{2}{5}$

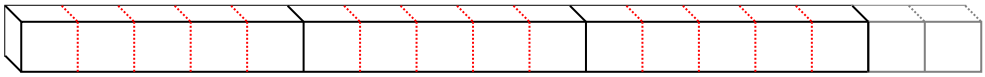

**8)** $9\frac{1}{5}$

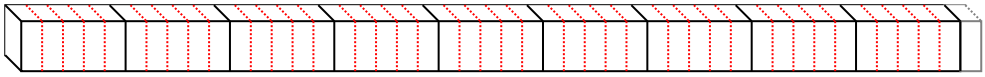

**9)** $9\frac{3}{4}$

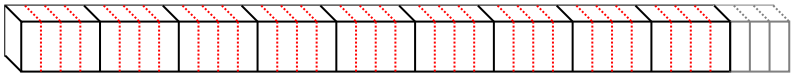

**10)** $1\frac{1}{2}$



## Ответы

| | |
|---|---|
| об. | 23 |
| 1. | 46 |
| 2. | 44 |
| 3. | 22 |
| 4. | 22 |
| 5. | 26 |
| 6. | 7 |
| 7. | 17 |
| 8. | 46 |
| 9. | 39 |
| 10. | 3 |



| 1-10 | 90 | 80 | 70 | 60 | 50 | 40 | 30 | 20 | 10 | 0 |
|---|---|---|---|---|---|---|---|---|---|---|