Нахождение объема при помощи малых кубов Имя:

Определите все при измерения параллелепипеда. Затем найдите объем.

об)

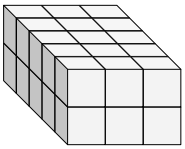

1)

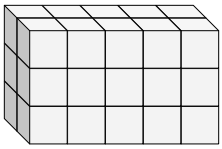

2)

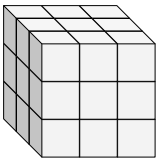

3)

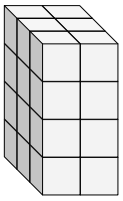

4)

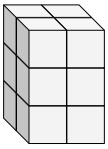

5)

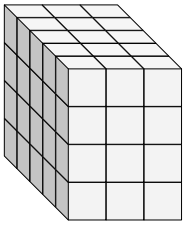

6)

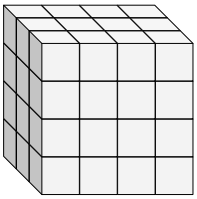

7)

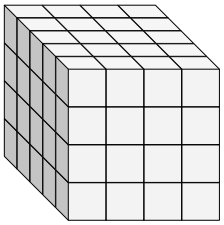

8)

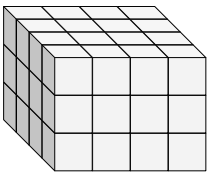

9)

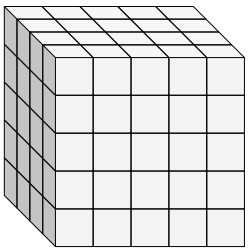

Ответы

об.	5	3	2	30
1.				
2.				
3.				
4.				
5.				
6.				
7.				
8.				
9.				

1-9	89	78	67	56	44	33	22	11	0

Нахождение объема при помощи малых кубов Имя: Ключ к правильным ответам

Определите все при измерения параллелепипеда. Затем найдите объем.

об)

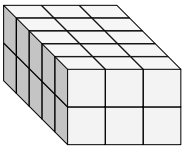

1)

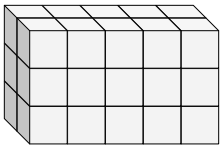

2)

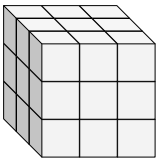

3)

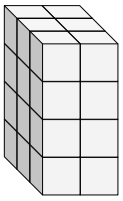

4)

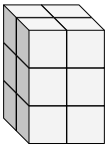

5)

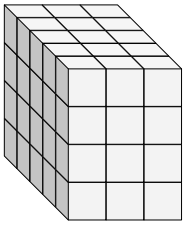

6)

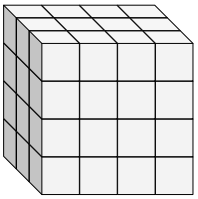

7)

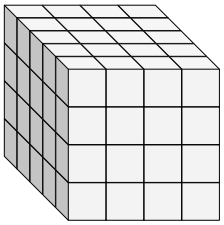

8)

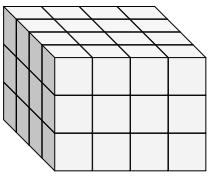

9)

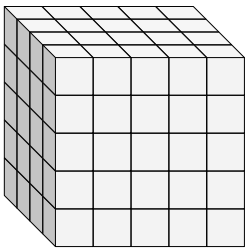

Ответы

об.	5	3	2	30
1.	2	5	3	30
2.	3	3	3	27
3.	3	2	4	24
4.	2	2	3	12
5.	5	3	4	60
6.	3	4	4	48
7.	5	4	4	80
8.	4	4	3	48
9.	4	5	5	100

1-9	89	78	67	56	44	33	22	11	0