Нахождение объема при помощи малых кубов Имя:

Определите все при измерения параллелепипеда. Затем найдите объем.

об)

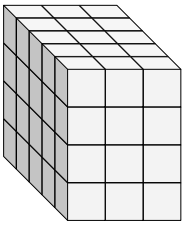

1)

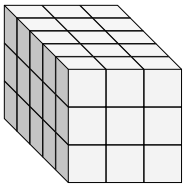

2)

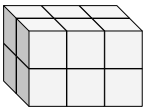

3)

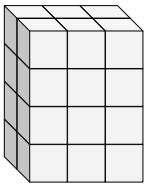

4)

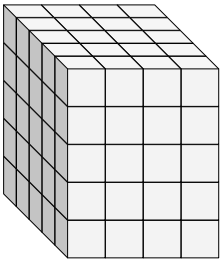

5)

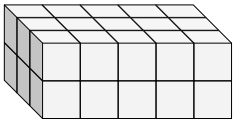

6)

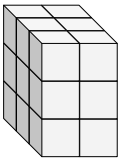

7)

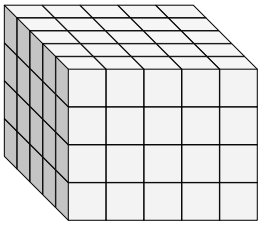

8)

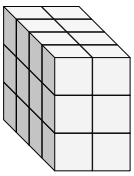

9)

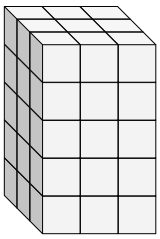

Ответы

об.	5	3	4	60
1.				
2.				
3.				
4.				
5.				
6.				
7.				
8.				
9.				

1-9	89	78	67	56	44	33	22	11	0

Нахождение объема при помощи малых кубов Имя: Ключ к правильным ответам

Определите все при измерения параллелепипеда. Затем найдите объем.

об)

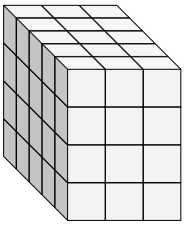

1)

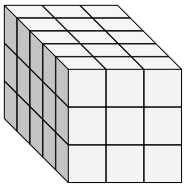

2)

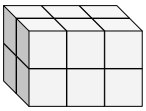

3)

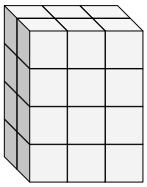

4)

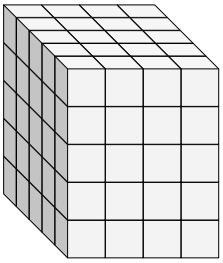

5)

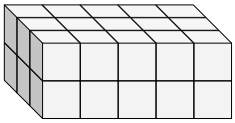

6)

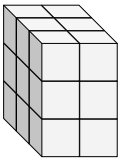

7)

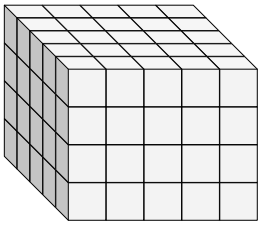

8)

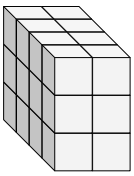

9)

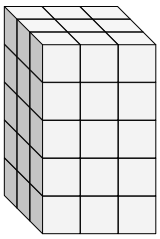

Ответы

об.	5	3	4	60
1.	5	3	3	45
2.	2	3	2	12
3.	2	3	4	24
4.	5	4	5	100
5.	3	5	2	30
6.	3	2	3	18
7.	5	5	4	100
8.	4	2	3	24
9.	3	3	5	45

1-9	89	78	67	56	44	33	22	11	0