Определение объема коробки Имя:

Определите объем каждой коробки. Каждый блок равен 1 кубической единице (и 3).

1)

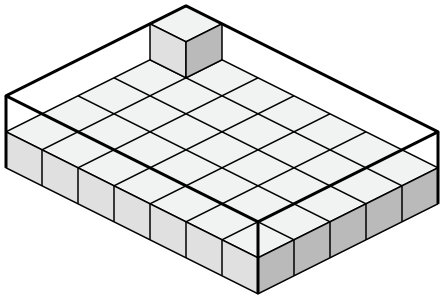

2)

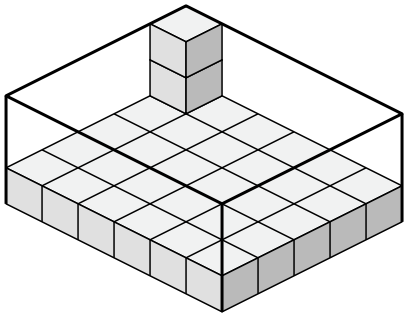

3)

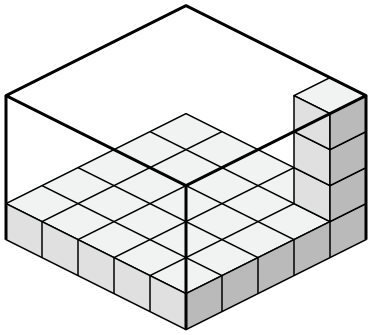

4)

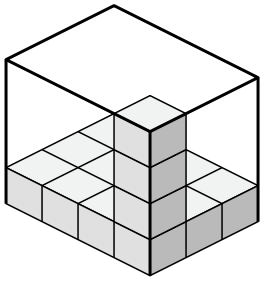

5)

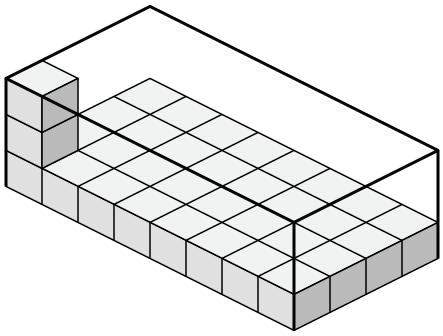

6)

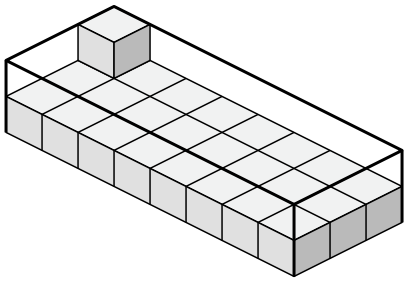

7)

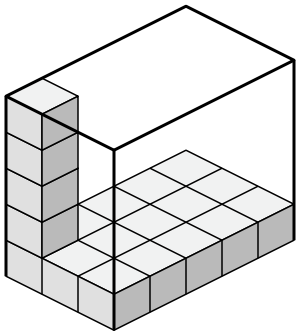

8)

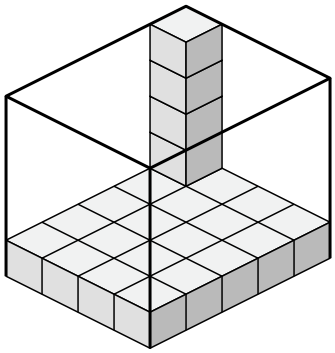

Ответы

1. _____
2. _____
3. _____
4. _____
5. _____
6. _____
7. _____
8. _____

1-8	88	75	63	50	38	25	13	0

Определение объема коробки Имя: Ключ к правильным ответам

Определите объем каждой коробки. Каждый блок равен 1 кубической единице (u 3).

1)

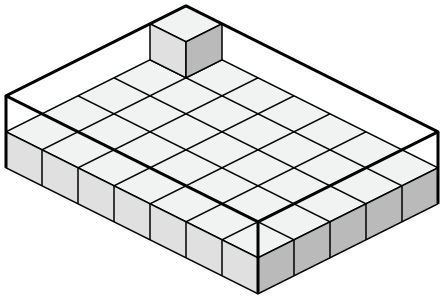

2)

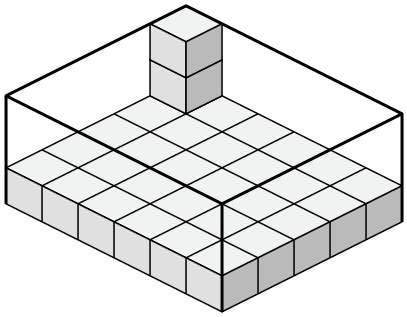

3)

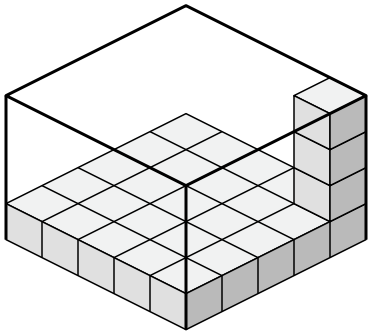

4)

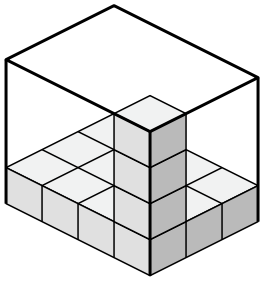

5)

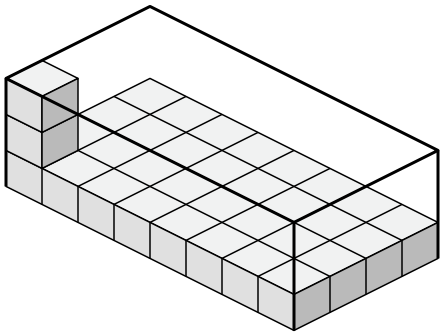

6)

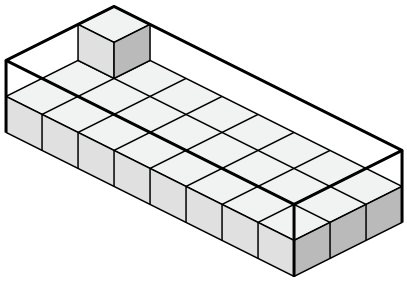

7)

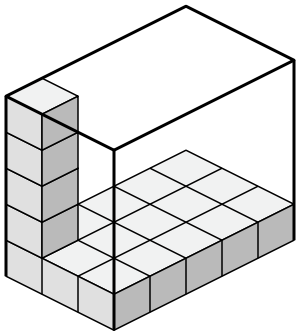

8)

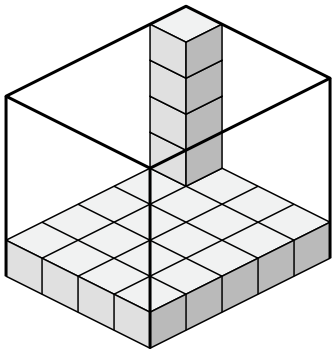

Ответы

1. 70 u^3
2. 90 u^3
3. 100 u^3
4. 48 u^3
5. 96 u^3
6. 48 u^3
7. 75 u^3
8. 100 u^3

1-8	88	75	63	50	38	25	13	0