**Найдите значение «a» и «b». Угол XQR составляет 180 °.**

**1)**

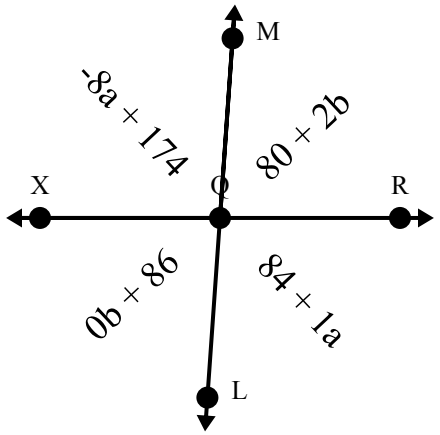


**2)**

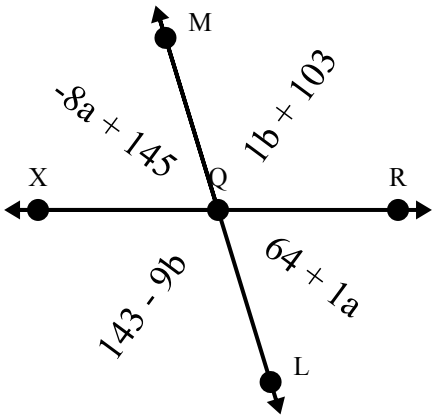


**3)**

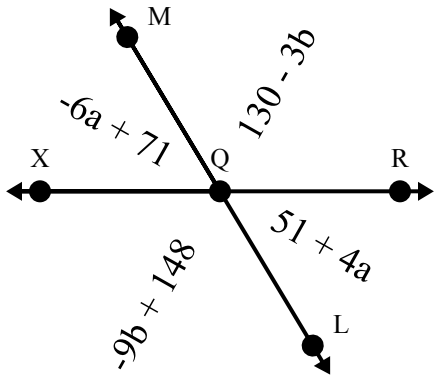


**4)**

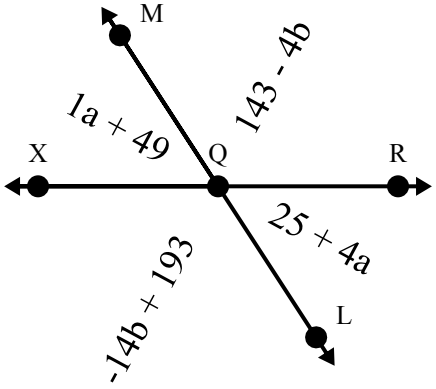


**5)**

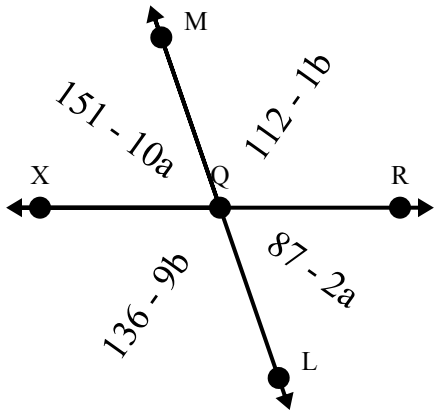


**6)**

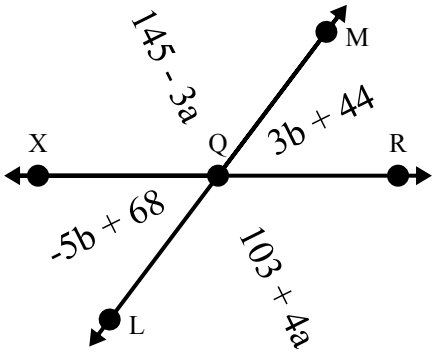


**7)**

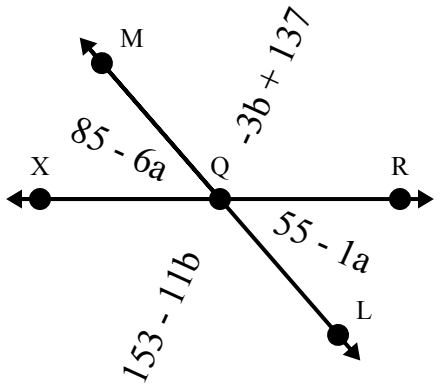


**8)**

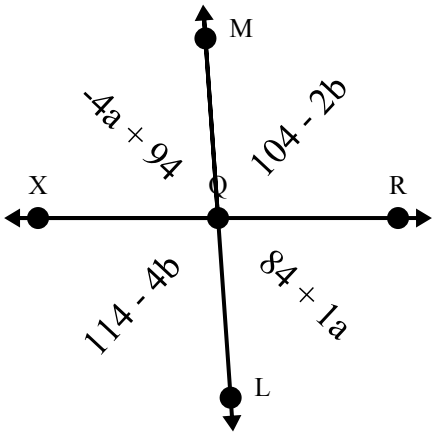


## Ответы

1. _____ _____
2. _____ _____
3. _____ _____
4. _____ _____
5. _____ _____
6. _____ _____
7. _____ _____
8. _____ _____



| 1-8 | 88 | 75 | 63 | 50 | 38 | 25 | 13 | 0 |
|---|---|---|---|---|---|---|---|---|

**Найдите значение «a» и «b». Угол XQR составляет 180 °.**

1)

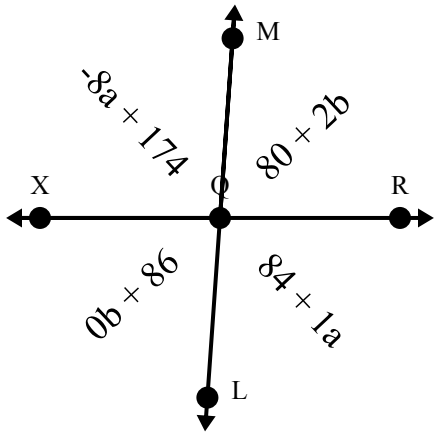


2)

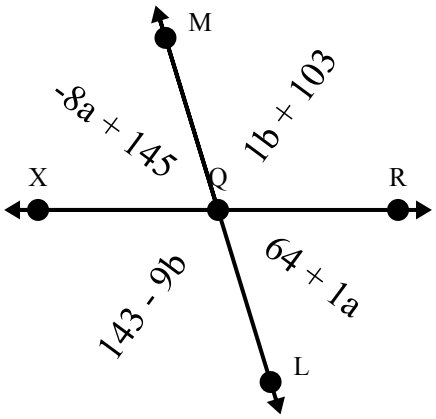


3)

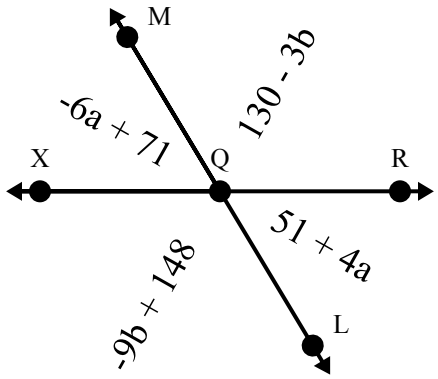


4)

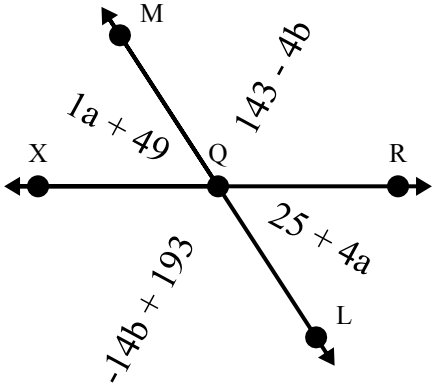


5)

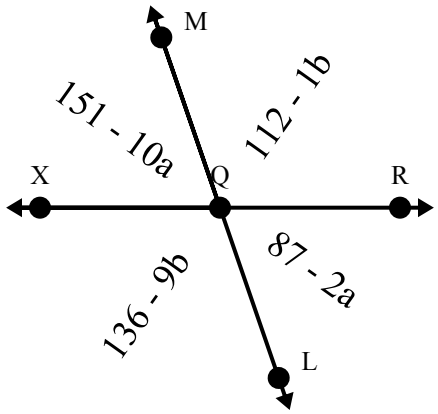


6)

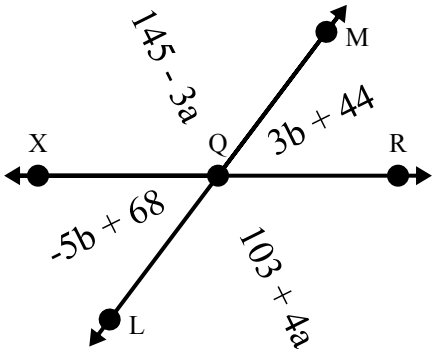


7)

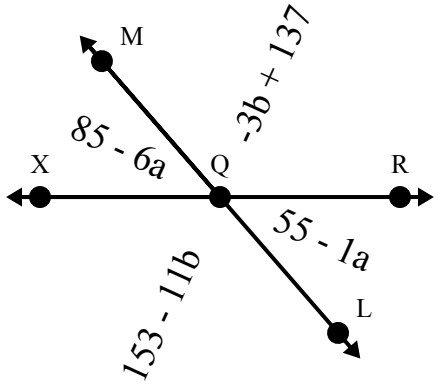


8)

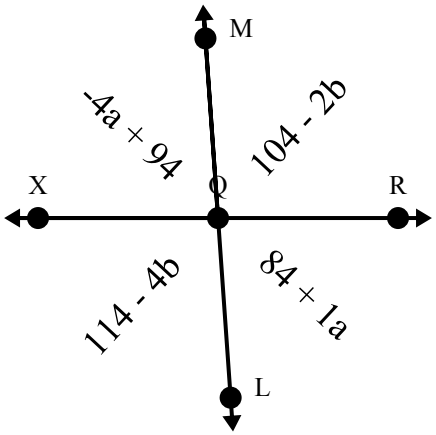


## Ответы

| | | |
|---|---|---|
| 1. | 10 | 3 |
| 2. | 9 | 4 |
| 3. | 2 | 3 |
| 4. | 8 | 5 |
| 5. | 8 | 3 |
| 6. | 6 | 3 |
| 7. | 6 | 2 |
| 8. | 2 | 5 |



| 1-8 | 88 | 75 | 63 | 50 | 38 | 25 | 13 | 0 |
|---|---|---|---|---|---|---|---|---|