Поиск дополнительных углов Имя:

**Найдите значение «A» в наборе дополнительных углов.**

**1)**

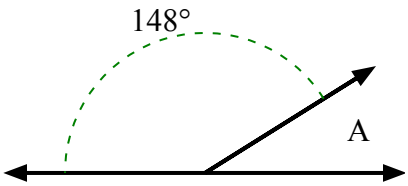


**2)**

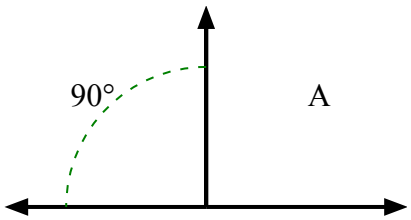


**3)**

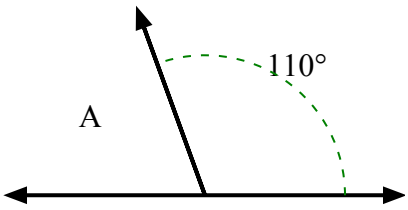


**4)**

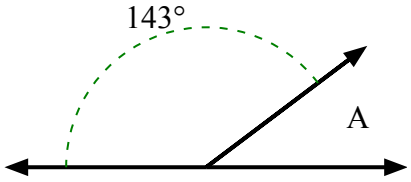


**5)**

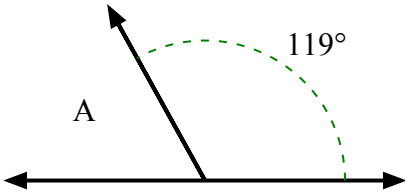


**6)**

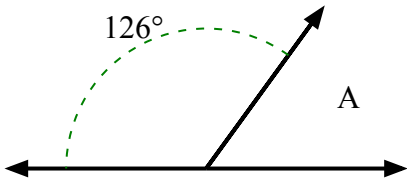


**7)**

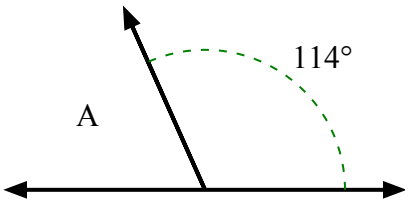


**8)**

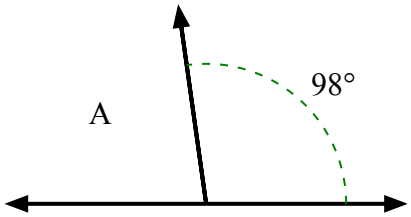


**9)**

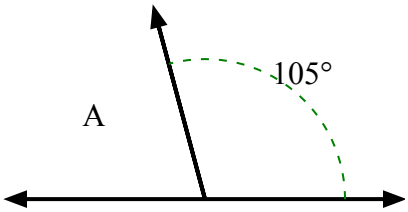


**10)**

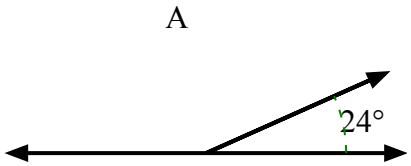


**Ответы**

1. _____
2. _____
3. _____
4. _____
5. _____
6. _____
7. _____
8. _____
9. _____
10. _____



| 1-10 | 90 | 80 | 70 | 60 | 50 | 40 | 30 | 20 | 10 | 0 |
|---|---|---|---|---|---|---|---|---|---|---|

Поиск дополнительных углов Имя: Ключ к правильным ответам

**Найдите значение «A» в наборе дополнительных углов.**

**1)**

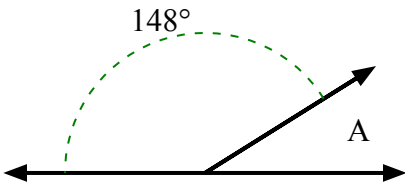


**2)**

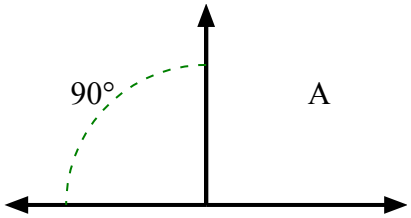


**3)**

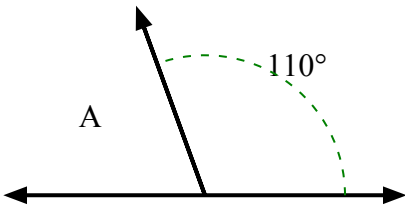


**4)**

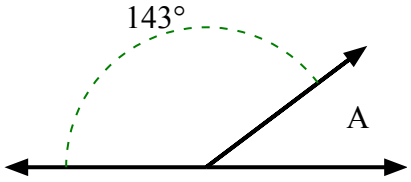


**5)**

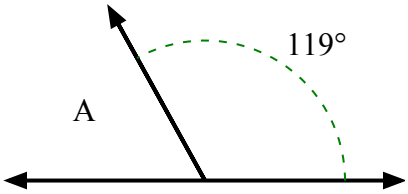


**6)**

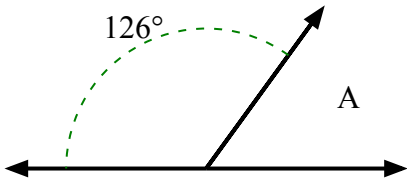


**7)**

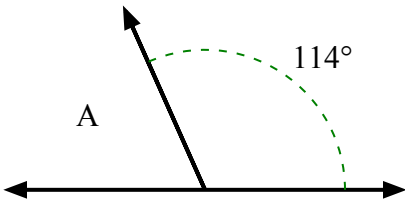


**8)**

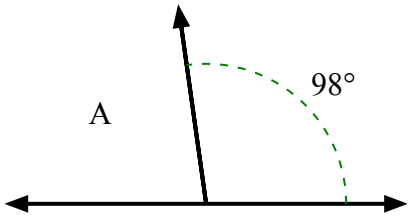


**9)**

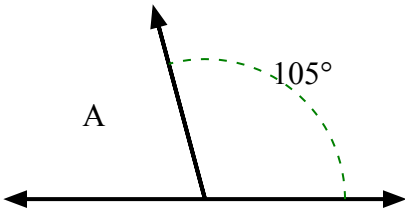


**10)**

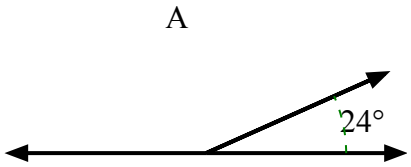


## Ответы

1. 32°
2. 90°
3. 70°
4. 37°
5. 61°
6. 54°
7. 66°
8. 82°
9. 75°
10. 156°



| 1-10 | 90 | 80 | 70 | 60 | 50 | 40 | 30 | 20 | 10 | 0 |
|---|---|---|---|---|---|---|---|---|---|---|