Определение площади по блокам Имя:

Определите площадь закрашенных фигур. Каждый блок равен 1 единице в квадрате (u^2).

1) 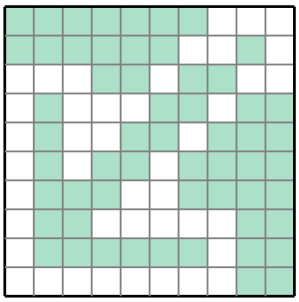

2) 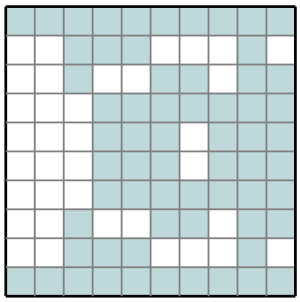

3) 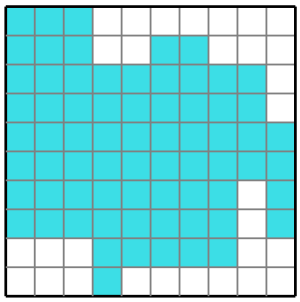

4) 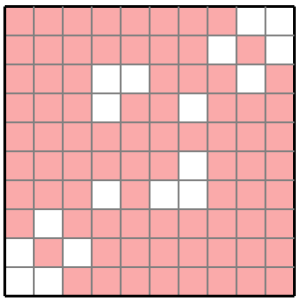

5) 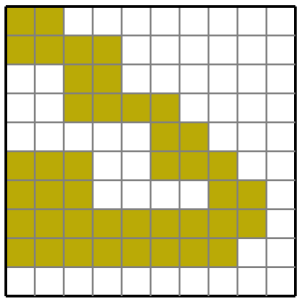

6) 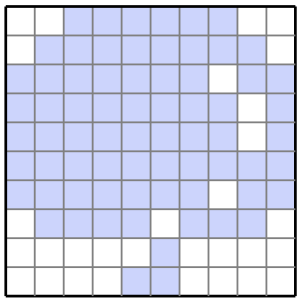

7) 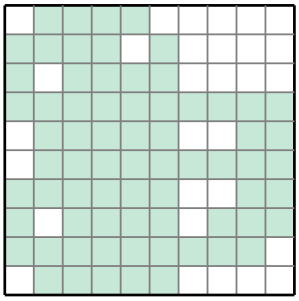

8) 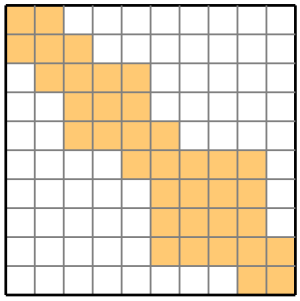

9) 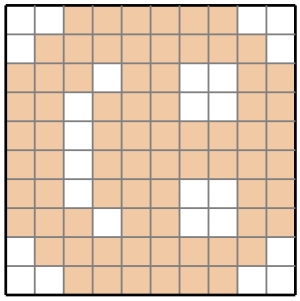

10) 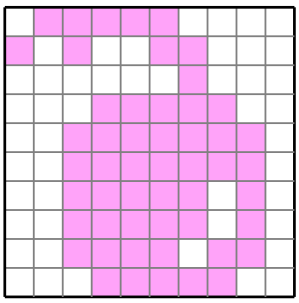

11) 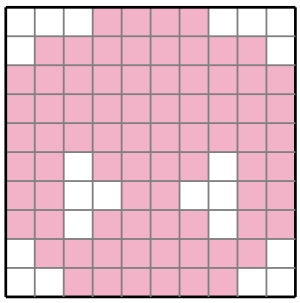

12) 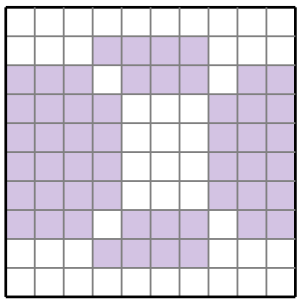

Ответы

1. _____
2. _____
3. _____
4. _____
5. _____
6. _____
7. _____
8. _____
9. _____
10. _____
11. _____
12. _____

1-10	92	83	75	67	58	50	42	33	25	17
11-12	8	0								

Определение площади по блокам Имя: **Ключ к правильным ответам**

Определите площадь закрашенных фигур. Каждый блок равен 1 единице в квадрате (u^2).

1)
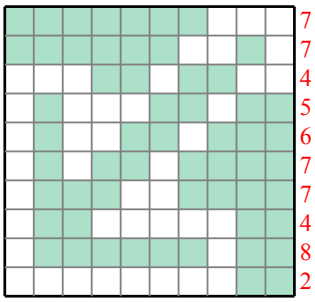

2)
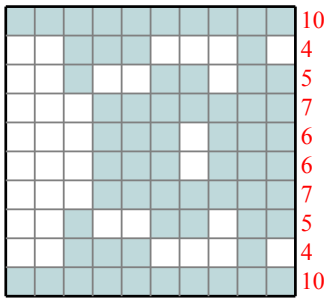

3)
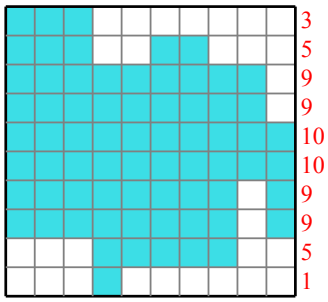

4)
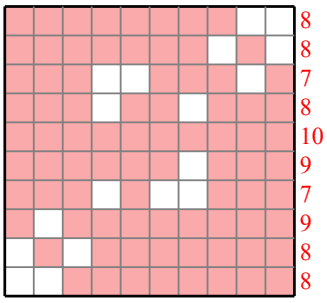

5)
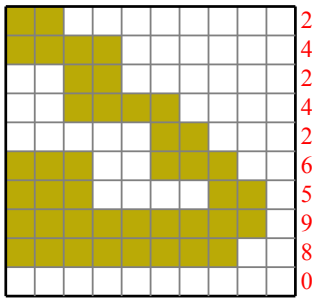

6)
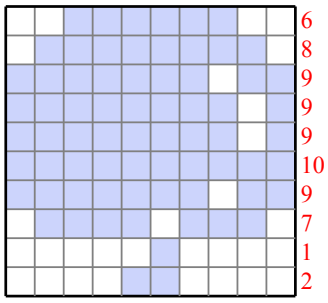

7)
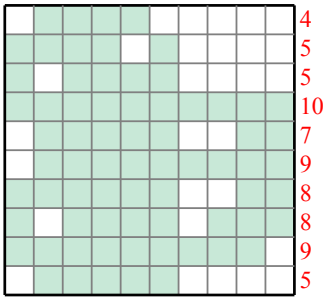

8)
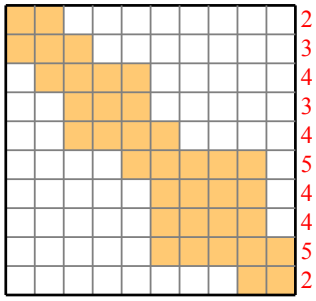

9)
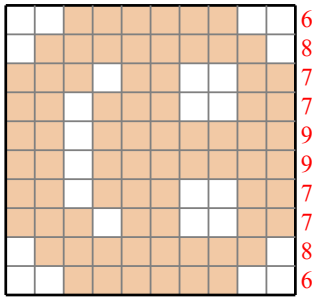

10)
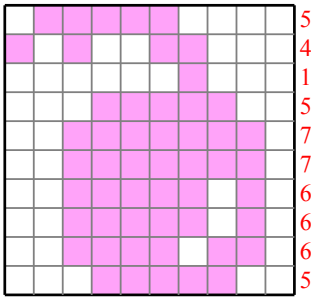

11)
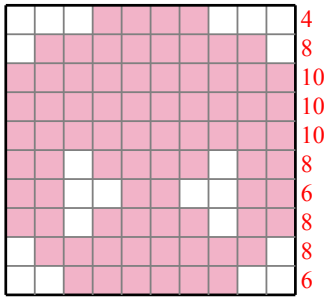

12)
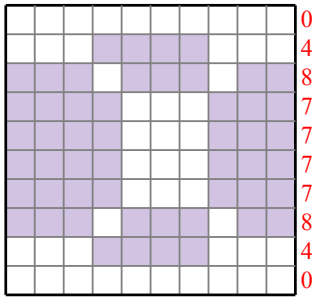

Ответы

1. **57 u^2**
2. **64 u^2**
3. **70 u^2**
4. **82 u^2**
5. **42 u^2**
6. **70 u^2**
7. **70 u^2**
8. **36 u^2**
9. **74 u^2**
10. **52 u^2**
11. **78 u^2**
12. **52 u^2**

1-10	92	83	75	67	58	50	42	33	25	17
11-12	8	0								