Определение площади Имя:

Определите площади прямоугольников.

1)

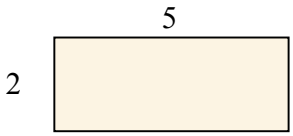

2)

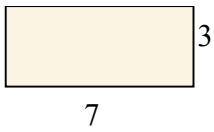

3)

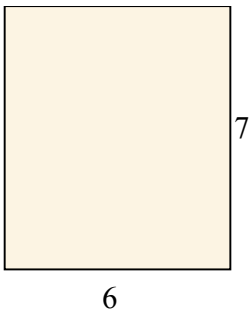

4)

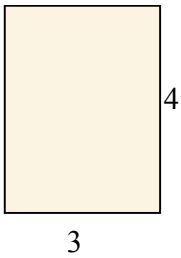

5)

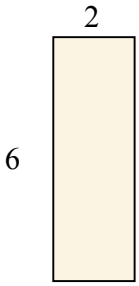

6)

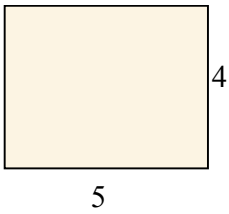

7)

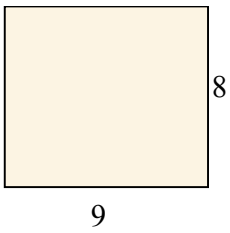

8)

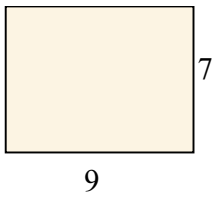

9)

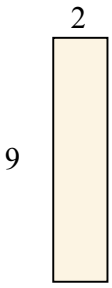

10)

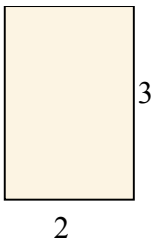

11)

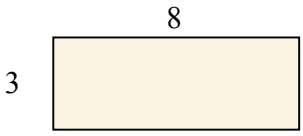

12)

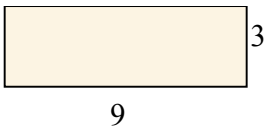

Ответы

1. _____
2. _____
3. _____
4. _____
5. _____
6. _____
7. _____
8. _____
9. _____
10. _____
11. _____
12. _____

1-10	92	83	75	67	58	50	42	33	25	17
11-12	8	0								

Определение площади

Имя: **Ключ к правильным ответам**

Определите площади прямоугольников.

1)

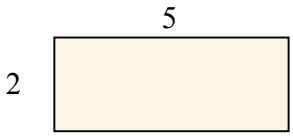

2)

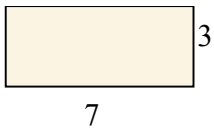

3)

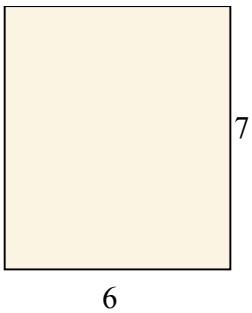

4)

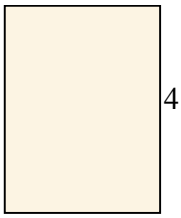

5)

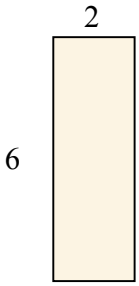

6)

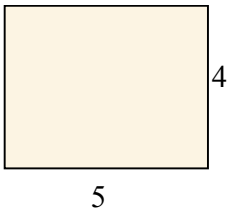

7)



8)



9)

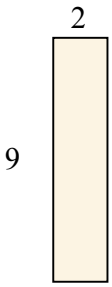

10)

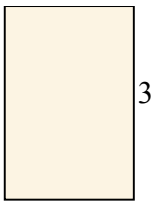

11)

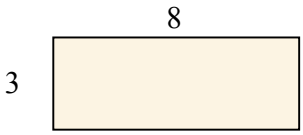

12)

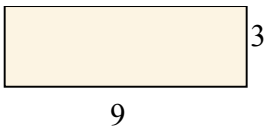

Ответы

1. **10**
2. **21**
3. **42**
4. **12**
5. **12**
6. **20**
7. **72**
8. **63**
9. **18**
10. **6**
11. **24**
12. **27**

1-10	92	83	75	67	58	50	42	33	25	17
11-12	8	0								