Найдите значение X для каждой цифры. Каждая цифра в сантиметрах (см). Не в масштабе.

1) площадь = 46,2257 cm^2

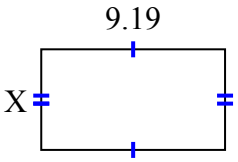

2) площадь = 34,336 cm^2

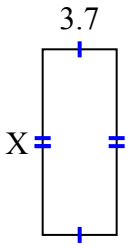

3) площадь = 32,745 cm^2

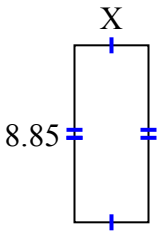

4) площадь = 18,504 cm^2

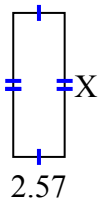

5) площадь = 29,15 cm^2

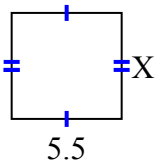

6) площадь = 78,71 cm^2

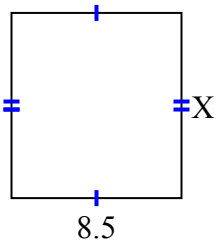

7) площадь = 45,0181 cm^2

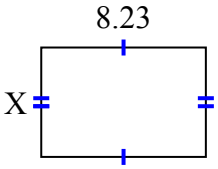

8) площадь = 66,272 cm^2

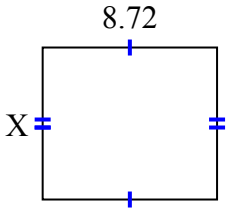

9) площадь = 27,72 cm^2

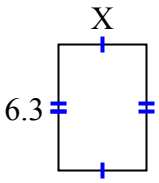

10) площадь = 43,99 cm^2

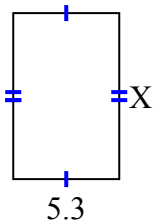

11) площадь = 57,216 cm^2

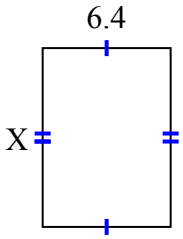

12) площадь = 21,336 cm^2

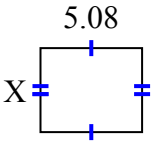

13) площадь = 87,141 cm^2

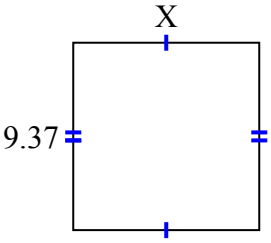

14) площадь = 22,41 cm^2

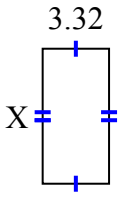

15) площадь = 31,62 cm^2

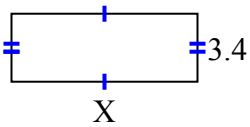

Ответы

1. _____
2. _____
3. _____
4. _____
5. _____
6. _____
7. _____
8. _____
9. _____
10. _____
11. _____
12. _____
13. _____
14. _____
15. _____

1-10	93	87	80	73	67	60	53	47	40	33
11-15	27	20	13	7	0					

Найдите значение X для каждой цифры. Каждая цифра в сантиметрах (см). Не в масштабе.

1) площадь = 46,2257 cm^2

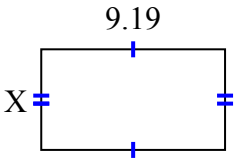

2) площадь = 34,336 cm^2

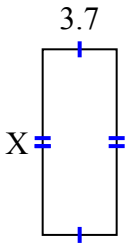

3) площадь = 32,745 cm^2

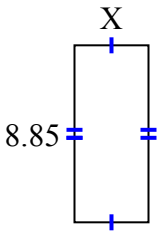

4) площадь = 18,504 cm^2

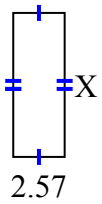

5) площадь = 29,15 cm^2

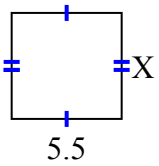

6) площадь = 78,71 cm^2

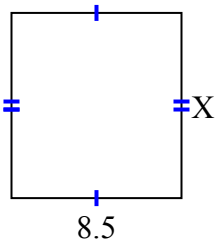

7) площадь = 45,0181 cm^2

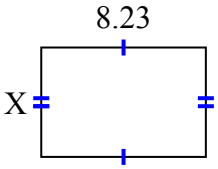

8) площадь = 66,272 cm^2

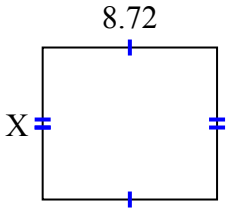

9) площадь = 27,72 cm^2

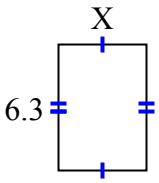

10) площадь = 43,99 cm^2

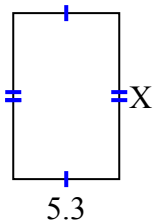

11) площадь = 57,216 cm^2

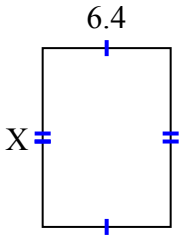

12) площадь = 21,336 cm^2

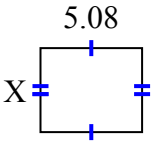

13) площадь = 87,141 cm^2

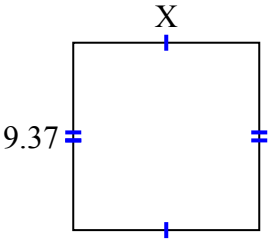

14) площадь = 22,41 cm^2

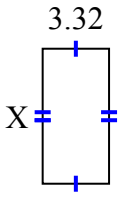

15) площадь = 31,62 cm^2

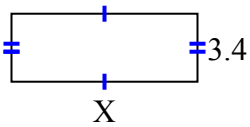

Ответы

1. 5.03
2. 9.28
3. 3.7
4. 7.2
5. 5.3
6. 9.26
7. 5.47
8. 7.6
9. 4.4
10. 8.3
11. 8.94
12. 4.2
13. 9.3
14. 6.75
15. 9.3

1-10	93	87	80	73	67	60	53	47	40	33
11-15	27	20	13	7	0					