Найдите значение X для каждой цифры. Каждая цифра в сантиметрах (см). Не в масштабе.

1) площадь = 15,04 cm^2

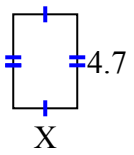

2) площадь = 33,7806 cm^2

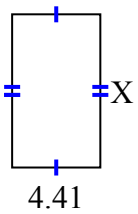

3) площадь = 52,219 cm^2

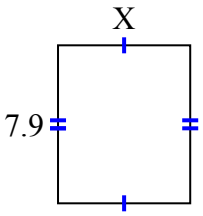

4) площадь = 31,525 cm^2

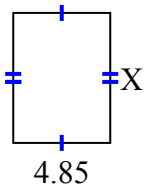

5) площадь = 39,61 cm^2

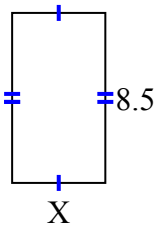

6) площадь = 8,5488 cm^2

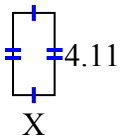

7) площадь = 33,2986 cm^2

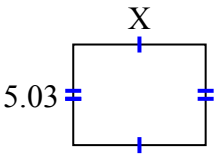

8) площадь = 94,941 cm^2

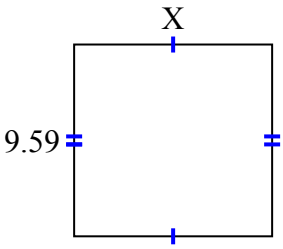

9) площадь = 34,02 cm^2

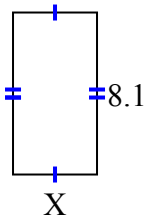

10) площадь = 21,09 cm^2

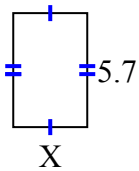

11) площадь = 59,04 cm^2

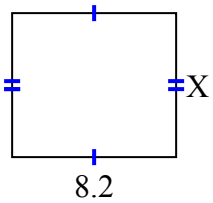

12) площадь = 48,972 cm^2

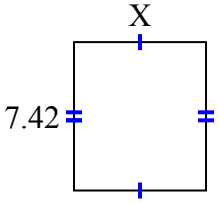

13) площадь = 28,21 cm^2

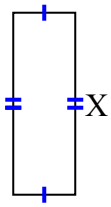

14) площадь = 44,84 cm^2

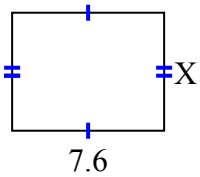

15) площадь = 25,755 cm^2

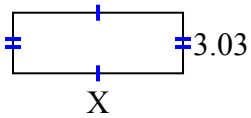

Ответы

1. _____
2. _____
3. _____
4. _____
5. _____
6. _____
7. _____
8. _____
9. _____
10. _____
11. _____
12. _____
13. _____
14. _____
15. _____

1-10	93	87	80	73	67	60	53	47	40	33
11-15	27	20	13	7	0					

Найдите значение X для каждой цифры. Каждая цифра в сантиметрах (см). Не в масштабе.

1) площадь = 15,04 cm^2

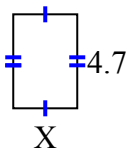

2) площадь = 33,7806 cm^2

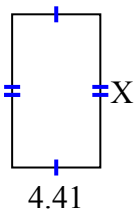

3) площадь = 52,219 cm^2

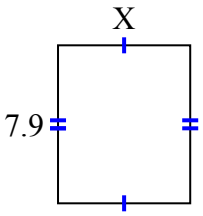

4) площадь = 31,525 cm^2

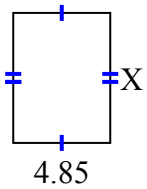

5) площадь = 39,61 cm^2

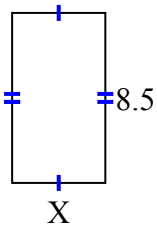

6) площадь = 8,5488 cm^2

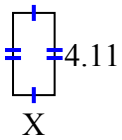

7) площадь = 33,2986 cm^2

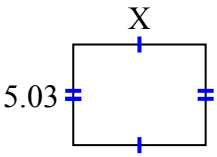

8) площадь = 94,941 cm^2

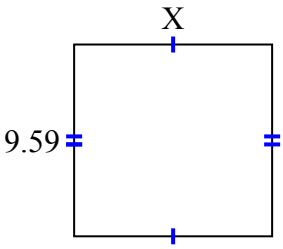

9) площадь = 34,02 cm^2

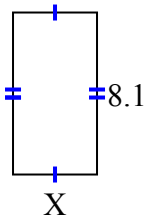

10) площадь = 21,09 cm^2

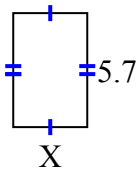

11) площадь = 59,04 cm^2

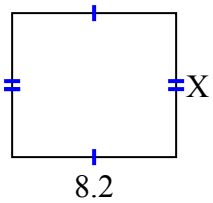

12) площадь = 48,972 cm^2

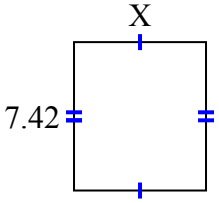

13) площадь = 28,21 cm^2

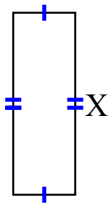

14) площадь = 44,84 cm^2

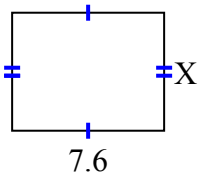

15) площадь = 25,755 cm^2

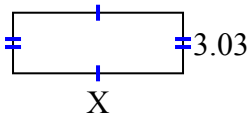

Ответы

1. 3.2
2. 7.66
3. 6.61
4. 6.5
5. 4.66
6. 2.08
7. 6.62
8. 9.9
9. 4.2
10. 3.7
11. 7.2
12. 6.6
13. 9.1
14. 5.9
15. 8.5

1-10	93	87	80	73	67	60	53	47	40	33
11-15	27	20	13	7	0					