Определите актуальную ширину, высоту и площадь каждого прямоугольника. Округлите площадь до целого числа.

1)

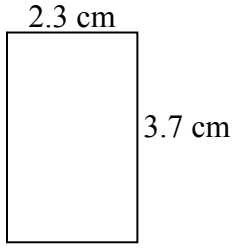

1 cm = 9 ft

2)

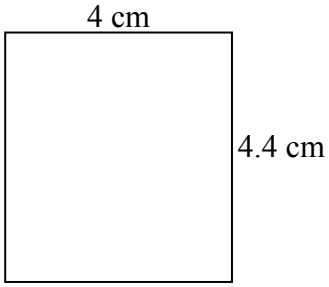

1 cm = 9 ft

3)

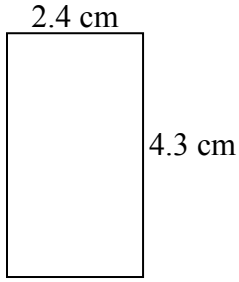

1 cm = 10 ft

4)

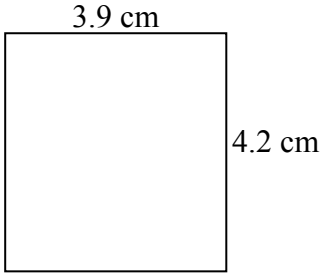

1 cm = 3 ft

5)

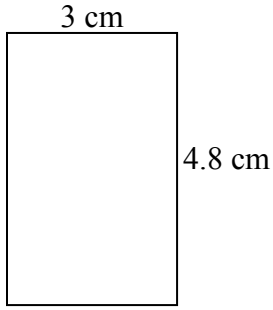

1 cm = 8 ft

6)

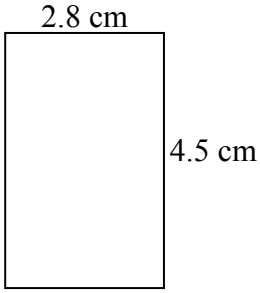

1 cm = 7 ft

7)

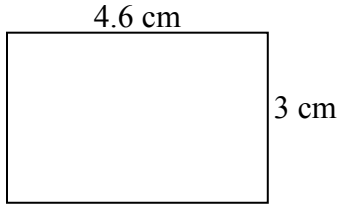

1 cm = 5 ft

8)

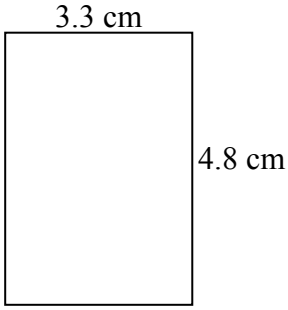

1 cm = 5 ft

Ответы

1. _____ _____ _____
2. _____ _____ _____
3. _____ _____ _____
4. _____ _____ _____
5. _____ _____ _____
6. _____ _____ _____
7. _____ _____ _____
8. _____ _____ _____

1-8	88	75	63	50	38	25	13	0

Определите актуальную ширину, высоту и площадь каждого прямоугольника. Округлите площадь до целого числа.

1)

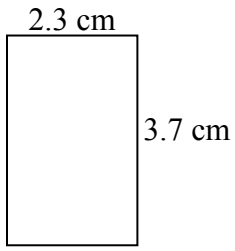

1 cm = 9 ft

2)

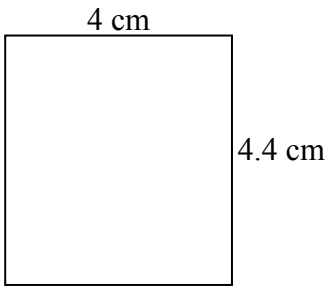

1 cm = 9 ft

3)

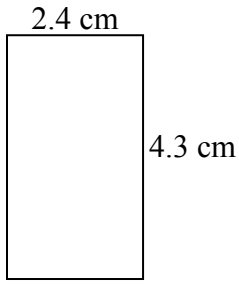

1 cm = 10 ft

4)

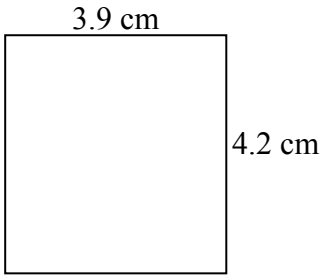

1 cm = 3 ft

5)

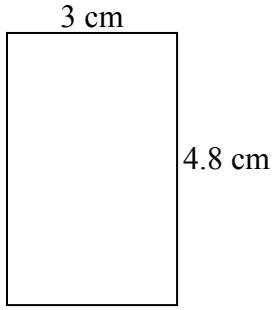

1 cm = 8 ft

6)

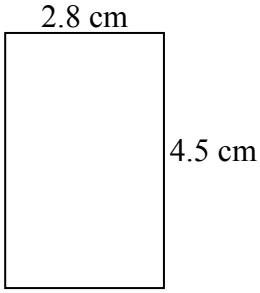

1 cm = 7 ft

7)

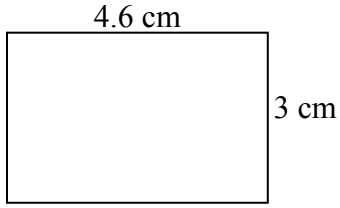

1 cm = 5 ft

8)

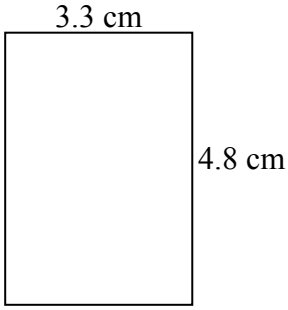

1 cm = 5 ft

Ответы

1.	20.7	33.3	689
2.	36	39.6	1 426
3.	24	43	1 032
4.	11.7	12.6	147
5.	24	38.4	922
6.	19.6	31.5	617
7.	23	15	345
8.	16.5	24	396

1-8	88	75	63	50	38	25	13	0

Определите актуальную ширину, высоту и площадь каждого прямоугольника. Округлите площадь до целого числа.

1)

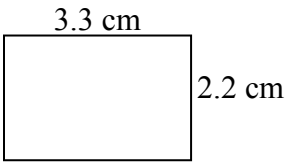

1 cm = 9 ft

2)

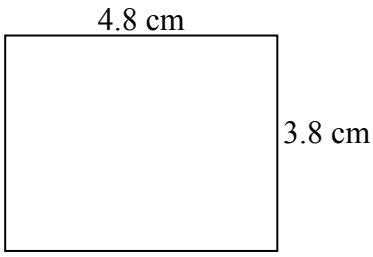

1 cm = 7 ft

3)

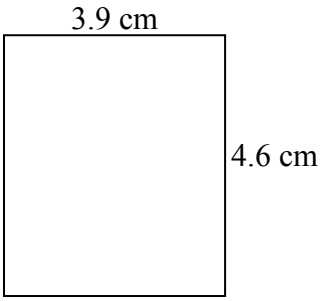

1 cm = 2 ft

4)

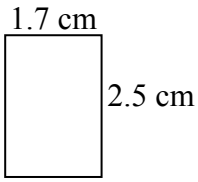

1 cm = 9 ft

5)

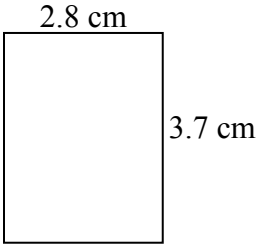

1 cm = 6 ft

6)

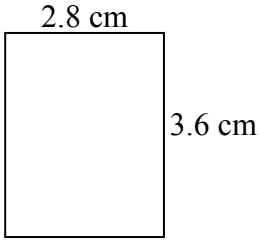

1 cm = 10 ft

7)

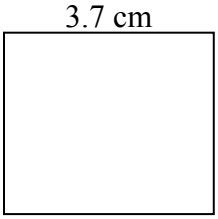

1 cm = 10 ft

8)

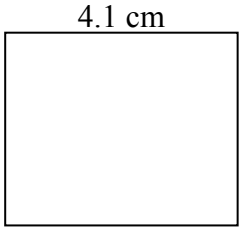

1 cm = 6 ft

Ответы

1. _____ _____ _____
2. _____ _____ _____
3. _____ _____ _____
4. _____ _____ _____
5. _____ _____ _____
6. _____ _____ _____
7. _____ _____ _____
8. _____ _____ _____

1-8	88	75	63	50	38	25	13	0

Определите актуальную ширину, высоту и площадь каждого прямоугольника. Округлите площадь до целого числа.

1)

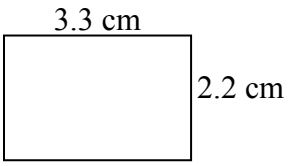

1 cm = 9 ft

2)

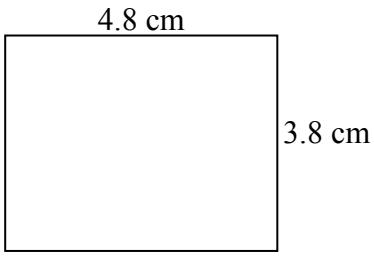

1 cm = 7 ft

3)

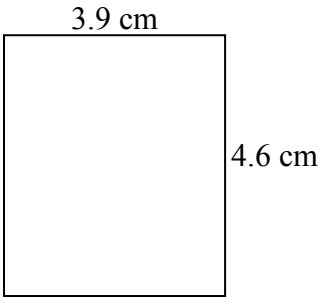

1 cm = 2 ft

4)

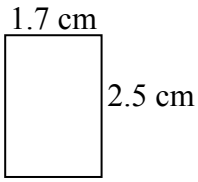

1 cm = 9 ft

5)

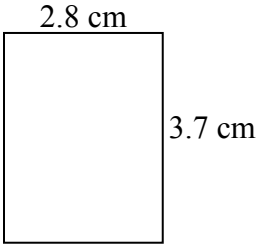

1 cm = 6 ft

6)

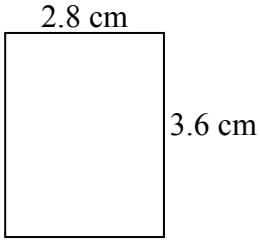

1 cm = 10 ft

7)

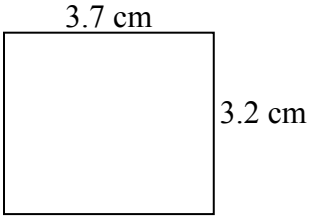

1 cm = 10 ft

8)

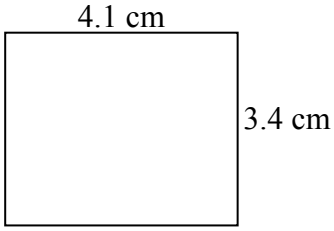

1 cm = 6 ft

Ответы

1.	29.7	19.8	588
2.	33.6	26.6	894
3.	7.8	9.2	72
4.	15.3	22.5	344
5.	16.8	22.2	373
6.	28	36	1 008
7.	37	32	1 184
8.	24.6	20.4	502

1-8	88	75	63	50	38	25	13	0

Определите актуальную ширину, высоту и площадь каждого прямоугольника. Округлите площадь до целого числа.

1)

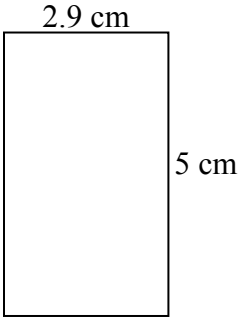

1 cm = 6 ft

2)

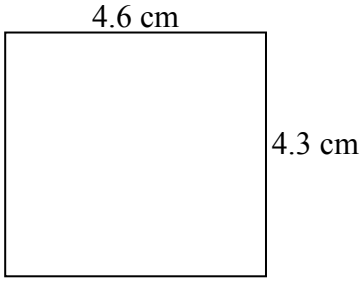

1 cm = 8 ft

3)

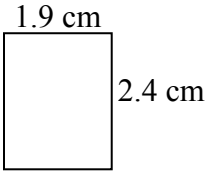

1 cm = 7 ft

4)

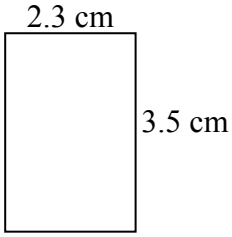

1 cm = 4 ft

5)

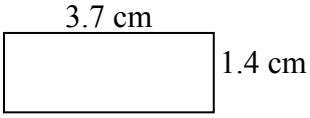

1 cm = 3 ft

6)

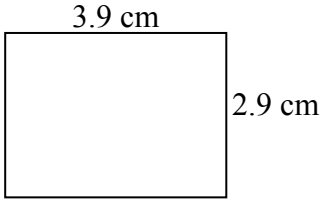

1 cm = 10 ft

7)

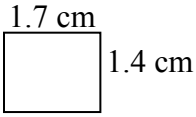

1 cm = 9 ft

8)

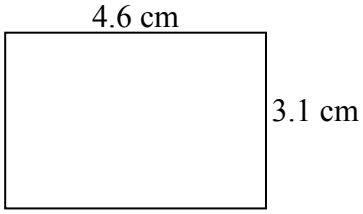

1 cm = 3 ft

Ответы

1. _____ _____ _____
2. _____ _____ _____
3. _____ _____ _____
4. _____ _____ _____
5. _____ _____ _____
6. _____ _____ _____
7. _____ _____ _____
8. _____ _____ _____

1-8	88	75	63	50	38	25	13	0

Определите актуальную ширину, высоту и площадь каждого прямоугольника. Округлите площадь до целого числа.

1)

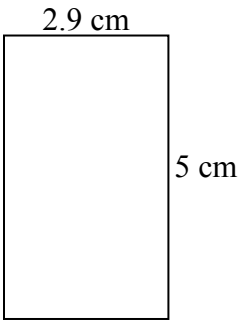

1 cm = 6 ft

2)

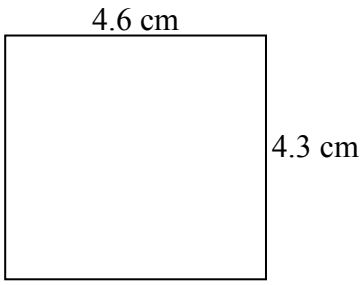

1 cm = 8 ft

3)

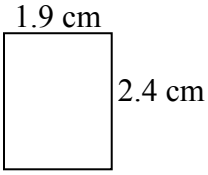

1 cm = 7 ft

4)

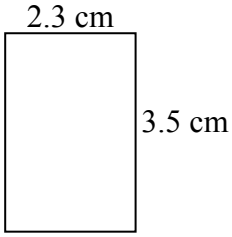

1 cm = 4 ft

5)

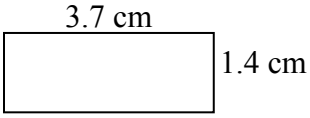

1 cm = 3 ft

6)

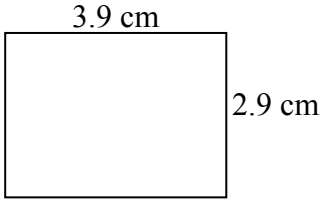

1 cm = 10 ft

7)

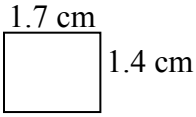

1 cm = 9 ft

8)

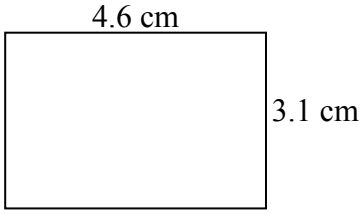

1 cm = 3 ft

Ответы

1.	17.4	30	522
2.	36.8	34.4	1 266
3.	13.3	16.8	223
4.	9.2	14	129
5.	11.1	4.2	47
6.	39	29	1 131
7.	15.3	12.6	193
8.	13.8	9.3	128

1-8	88	75	63	50	38	25	13	0

Определите актуальную ширину, высоту и площадь каждого прямоугольника. Округлите площадь до целого числа.

1)

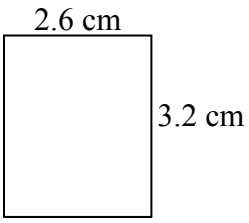

1 cm = 5 ft

2)

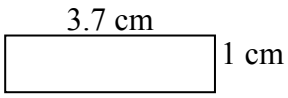

1 cm = 2 ft

3)

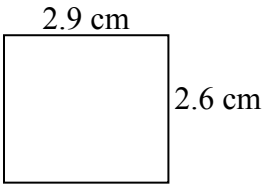

1 cm = 3 ft

4)

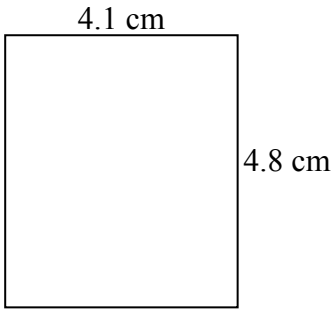

1 cm = 4 ft

5)

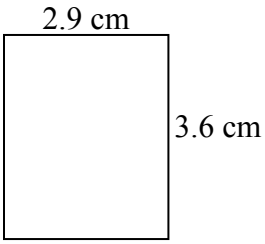

1 cm = 7 ft

6)

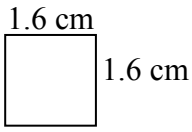

1 cm = 6 ft

7)

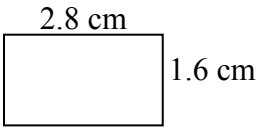

1 cm = 3 ft

8)

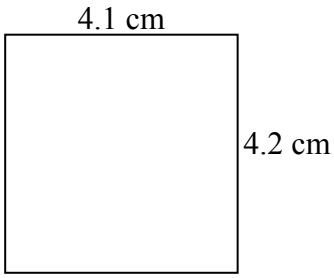

1 cm = 5 ft

Ответы

1. _____ _____ _____
2. _____ _____ _____
3. _____ _____ _____
4. _____ _____ _____
5. _____ _____ _____
6. _____ _____ _____
7. _____ _____ _____
8. _____ _____ _____

1-8	88	75	63	50	38	25	13	0

Определите актуальную ширину, высоту и площадь каждого прямоугольника. Округлите площадь до целого числа.

1)

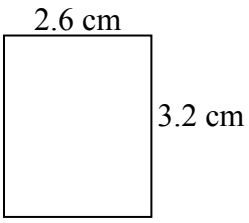

1 cm = 5 ft

2)

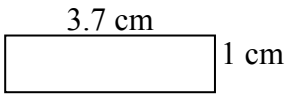

1 cm = 2 ft

3)

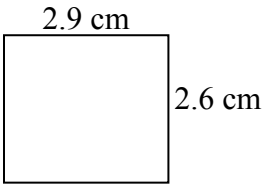

1 cm = 3 ft

4)

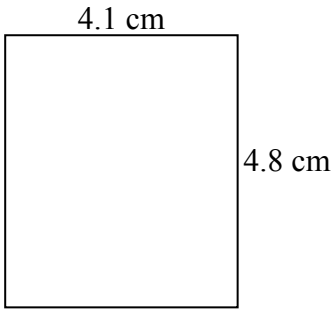

1 cm = 4 ft

5)

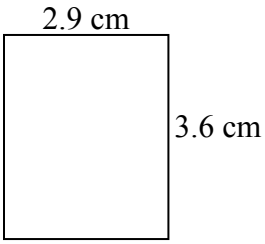

1 cm = 7 ft

6)

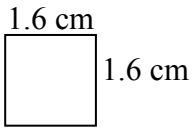

1 cm = 6 ft

7)

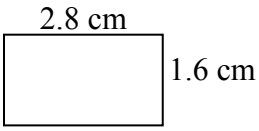

1 cm = 3 ft

8)

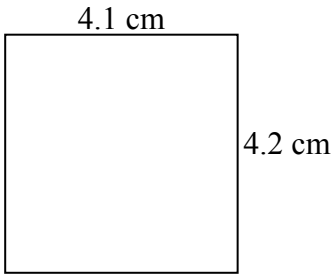

1 cm = 5 ft

Ответы

1.	13	16	208
2.	7.4	2	15
3.	8.7	7.8	68
4.	16.4	19.2	315
5.	20.3	25.2	512
6.	9.6	9.6	92
7.	8.4	4.8	40
8.	20.5	21	431

1-8	88	75	63	50	38	25	13	0

Определите актуальную ширину, высоту и площадь каждого прямоугольника. Округлите площадь до целого числа.

1)

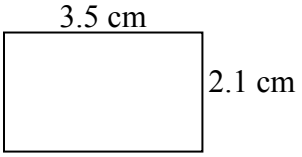

1 cm = 3 ft

2)

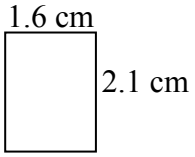

1 cm = 5 ft

3)



1 cm = 5 ft

4)

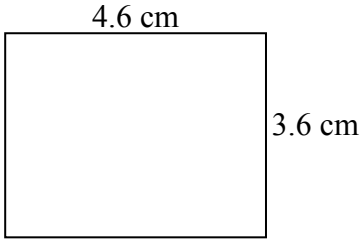

1 cm = 3 ft

5)

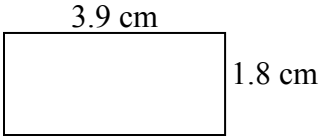

1 cm = 3 ft

6)

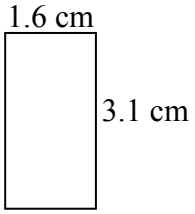

1 cm = 7 ft

7)

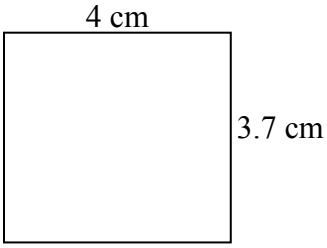

1 cm = 4 ft

8)

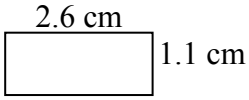

1 cm = 6 ft

Ответы

1. _____ _____ _____
2. _____ _____ _____
3. _____ _____ _____
4. _____ _____ _____
5. _____ _____ _____
6. _____ _____ _____
7. _____ _____ _____
8. _____ _____ _____

1-8	88	75	63	50	38	25	13	0

Определите актуальную ширину, высоту и площадь каждого прямоугольника. Округлите площадь до целого числа.

1)

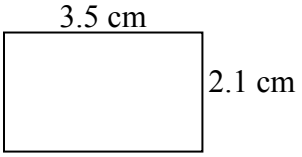

1 cm = 3 ft

2)

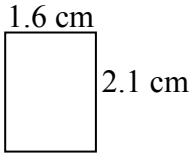

1 cm = 5 ft

3)



1 cm = 5 ft

4)

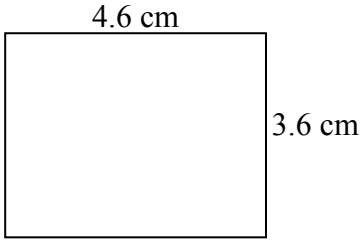

1 cm = 3 ft

5)

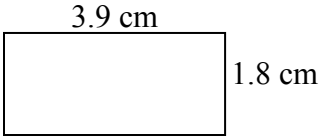

1 cm = 3 ft

6)

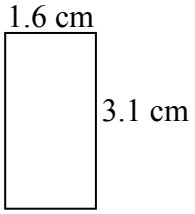

1 cm = 7 ft

7)

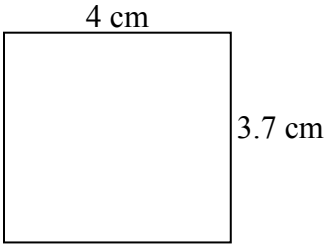

1 cm = 4 ft

8)

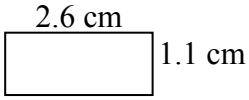

1 cm = 6 ft

Ответы

1.	10.5	6.3	66
2.	8	10.5	84
3.	9	20.5	185
4.	13.8	10.8	149
5.	11.7	5.4	63
6.	11.2	21.7	243
7.	16	14.8	237
8.	15.6	6.6	103

1-8	88	75	63	50	38	25	13	0

Определите актуальную ширину, высоту и площадь каждого прямоугольника. Округлите площадь до целого числа.

1)

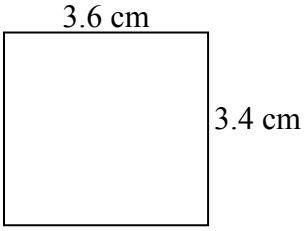

1 cm = 3 ft

2)

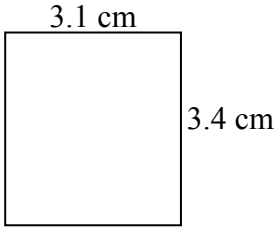

1 cm = 5 ft

3)

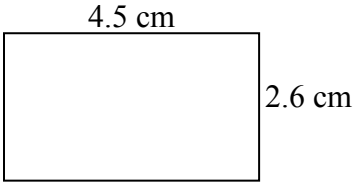

1 cm = 3 ft

4)

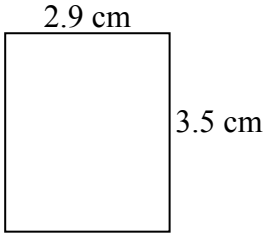

1 cm = 8 ft

5)

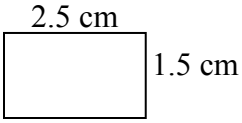

1 cm = 8 ft

6)

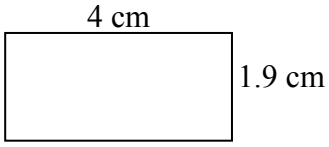

1 cm = 3 ft

7)

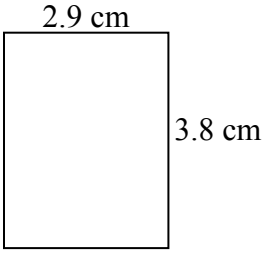

1 cm = 8 ft

8)

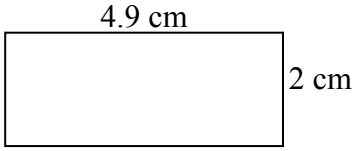

1 cm = 8 ft

Ответы

1. _____ _____ _____
2. _____ _____ _____
3. _____ _____ _____
4. _____ _____ _____
5. _____ _____ _____
6. _____ _____ _____
7. _____ _____ _____
8. _____ _____ _____

1-8	88	75	63	50	38	25	13	0

Определите актуальную ширину, высоту и площадь каждого прямоугольника. Округлите площадь до целого числа.

1)

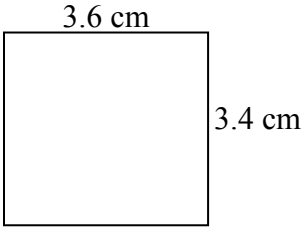

1 cm = 3 ft

2)

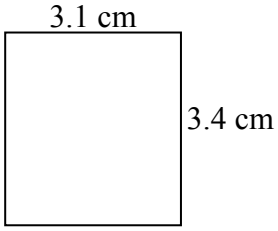

1 cm = 5 ft

3)

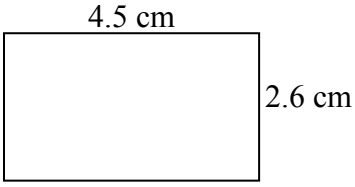

1 cm = 3 ft

4)

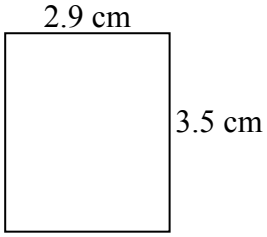

1 cm = 8 ft

5)

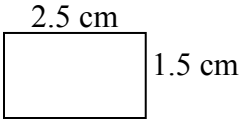

1 cm = 8 ft

6)

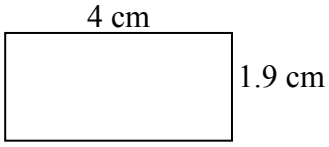

1 cm = 3 ft

7)

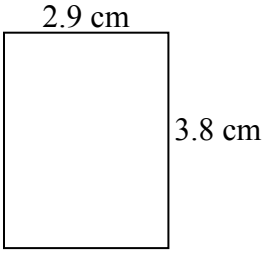

1 cm = 8 ft

8)

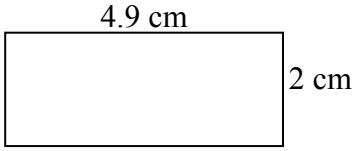

1 cm = 8 ft

Ответы

1.	10.8	10.2	110
2.	15.5	17	264
3.	13.5	7.8	105
4.	23.2	28	650
5.	20	12	240
6.	12	5.7	68
7.	23.2	30.4	705
8.	39.2	16	627

1-8	88	75	63	50	38	25	13	0

Определите актуальную ширину, высоту и площадь каждого прямоугольника. Округлите площадь до целого числа.

1)

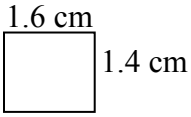

1 cm = 3 ft

2)

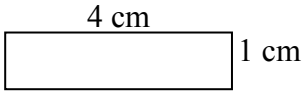

1 cm = 3 ft

3)

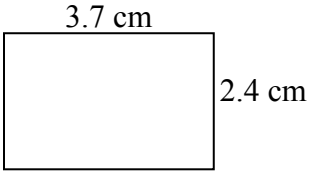

1 cm = 10 ft

4)

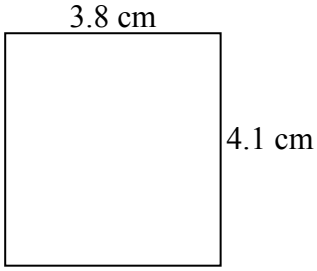

1 cm = 5 ft

5)

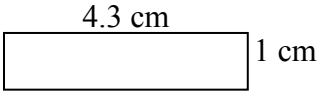

1 cm = 9 ft

6)

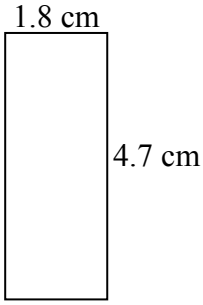

1 cm = 5 ft

7)

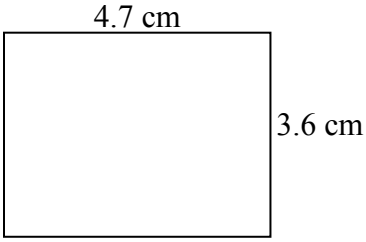

1 cm = 10 ft

8)

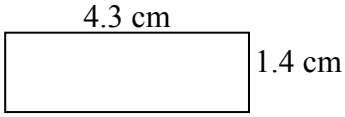

1 cm = 9 ft

Ответы

1. _____ _____ _____
2. _____ _____ _____
3. _____ _____ _____
4. _____ _____ _____
5. _____ _____ _____
6. _____ _____ _____
7. _____ _____ _____
8. _____ _____ _____

1-8	88	75	63	50	38	25	13	0

Определите актуальную ширину, высоту и площадь каждого прямоугольника. Округлите площадь до целого числа.

1)

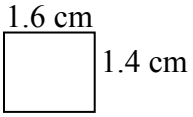

1 cm = 3 ft

2)

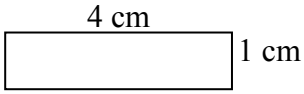

1 cm = 3 ft

3)

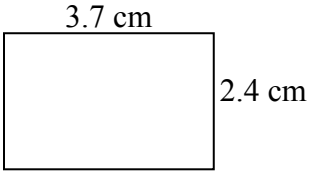

1 cm = 10 ft

4)

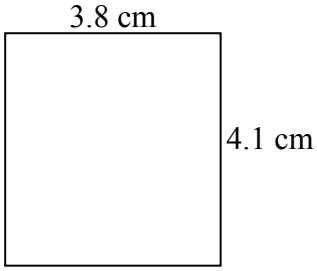

1 cm = 5 ft

5)

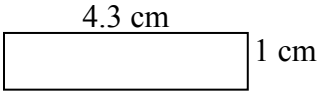

1 cm = 9 ft

6)

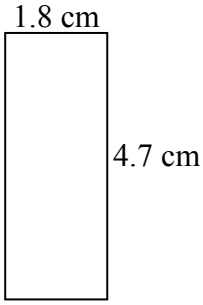

1 cm = 5 ft

7)

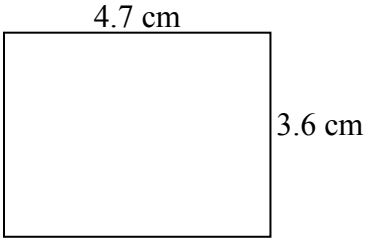

1 cm = 10 ft

8)

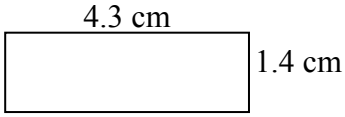

1 cm = 9 ft

Ответы

1.	4.8	4.2	20
2.	12	3	36
3.	37	24	888
4.	19	20.5	390
5.	38.7	9	348
6.	9	23.5	212
7.	47	36	1 692
8.	38.7	12.6	488

1-8	88	75	63	50	38	25	13	0

Определите актуальную ширину, высоту и площадь каждого прямоугольника. Округлите площадь до целого числа.

1)

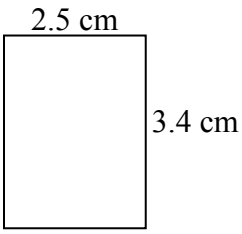

1 cm = 5 ft

2)

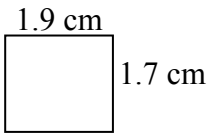

1 cm = 4 ft

3)

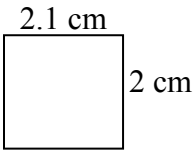

1 cm = 3 ft

4)

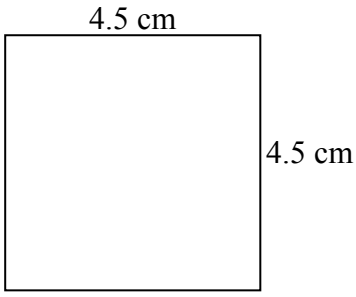

1 cm = 3 ft

5)

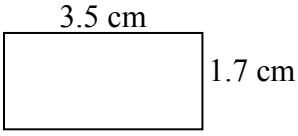

1 cm = 9 ft

6)

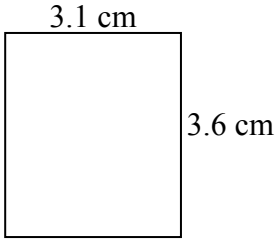

1 cm = 7 ft

7)

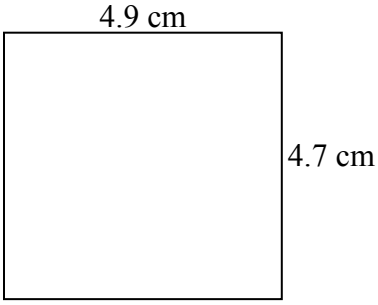

1 cm = 2 ft

8)

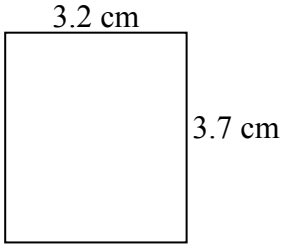

1 cm = 5 ft

Ответы

1. _____ _____ _____
2. _____ _____ _____
3. _____ _____ _____
4. _____ _____ _____
5. _____ _____ _____
6. _____ _____ _____
7. _____ _____ _____
8. _____ _____ _____

1-8	88	75	63	50	38	25	13	0

Определите актуальную ширину, высоту и площадь каждого прямоугольника. Округлите площадь до целого числа.

1)

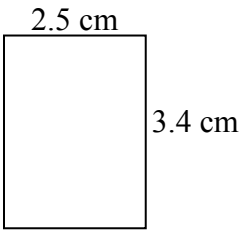

1 cm = 5 ft

2)

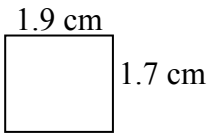

1 cm = 4 ft

3)

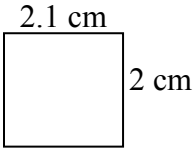

1 cm = 3 ft

4)

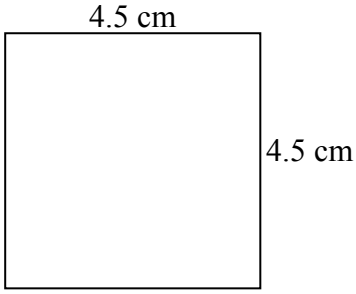

1 cm = 3 ft

5)

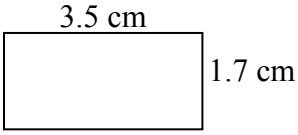

1 cm = 9 ft

6)

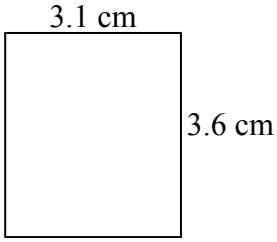

1 cm = 7 ft

7)

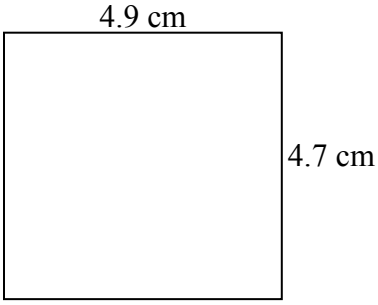

1 cm = 2 ft

8)

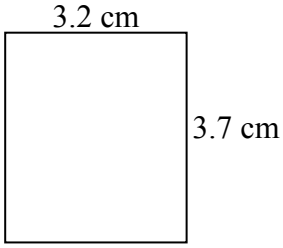

1 cm = 5 ft

Ответы

1.	12.5	17	213
2.	7.6	6.8	52
3.	6.3	6	38
4.	13.5	13.5	182
5.	31.5	15.3	482
6.	21.7	25.2	547
7.	9.8	9.4	92
8.	16	18.5	296

1-8	88	75	63	50	38	25	13	0

Определите актуальную ширину, высоту и площадь каждого прямоугольника. Округлите площадь до целого числа.

1)

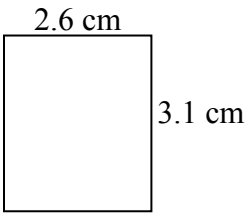

1 cm = 2 ft

2)

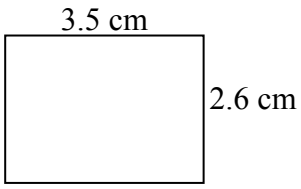

1 cm = 3 ft

3)

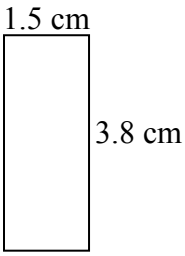

1 cm = 3 ft

4)

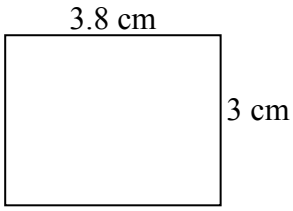

1 cm = 5 ft

5)

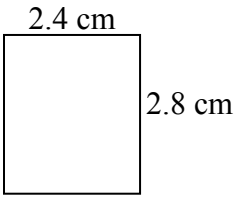

1 cm = 2 ft

6)

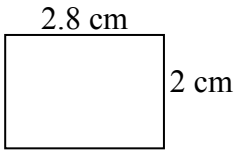

1 cm = 4 ft

7)

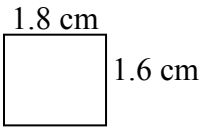

1 cm = 2 ft

8)



1 cm = 8 ft

Ответы

1. _____ _____ _____
2. _____ _____ _____
3. _____ _____ _____
4. _____ _____ _____
5. _____ _____ _____
6. _____ _____ _____
7. _____ _____ _____
8. _____ _____ _____

1-8	88	75	63	50	38	25	13	0

Определите актуальную ширину, высоту и площадь каждого прямоугольника. Округлите площадь до целого числа.

1)

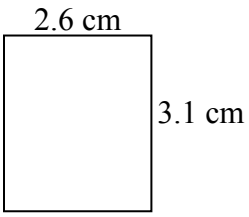

1 cm = 2 ft

2)

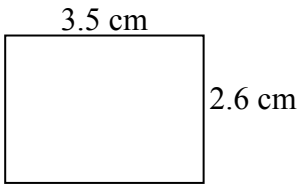

1 cm = 3 ft

3)



1 cm = 3 ft

4)

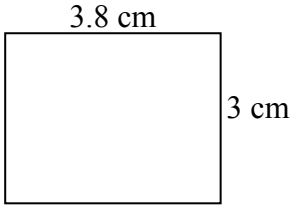

1 cm = 5 ft

5)

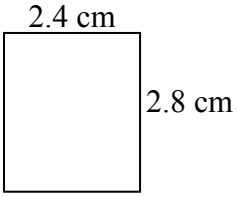

1 cm = 2 ft

6)

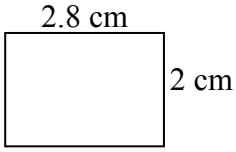

1 cm = 4 ft

7)

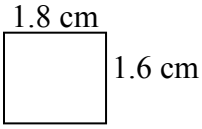

1 cm = 2 ft

8)

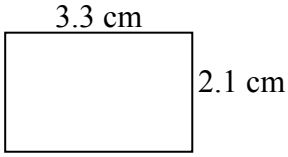

1 cm = 8 ft

Ответы

1.	5.2	6.2	32
2.	10.5	7.8	82
3.	4.5	11.4	51
4.	19	15	285
5.	4.8	5.6	27
6.	11.2	8	90
7.	3.6	3.2	12
8.	26.4	16.8	444

1-8	88	75	63	50	38	25	13	0

Определите актуальную ширину, высоту и площадь каждого прямоугольника. Округлите площадь до целого числа.

1)

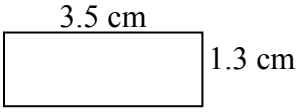

1 cm = 5 ft

2)

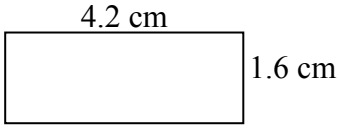

1 cm = 8 ft

3)

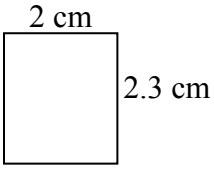

1 cm = 8 ft

4)

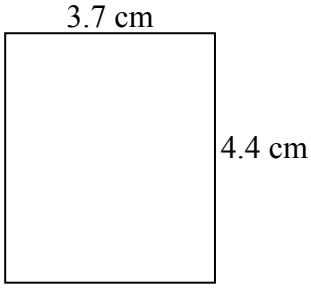

1 cm = 2 ft

5)

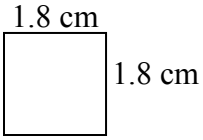

1 cm = 4 ft

6)

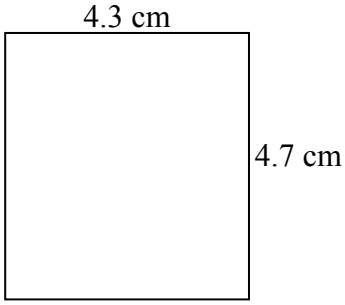

1 cm = 2 ft

7)

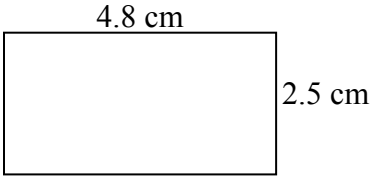

1 cm = 7 ft

8)

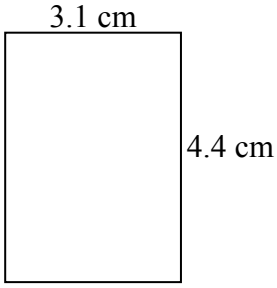

1 cm = 5 ft

Ответы

1. _____ _____ _____
2. _____ _____ _____
3. _____ _____ _____
4. _____ _____ _____
5. _____ _____ _____
6. _____ _____ _____
7. _____ _____ _____
8. _____ _____ _____

1-8	88	75	63	50	38	25	13	0

Определите актуальную ширину, высоту и площадь каждого прямоугольника. Округлите площадь до целого числа.

1)

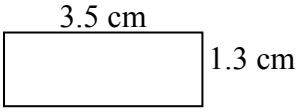

1 cm = 5 ft

2)

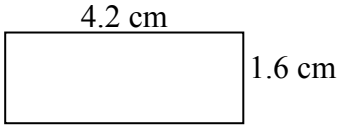

1 cm = 8 ft

3)

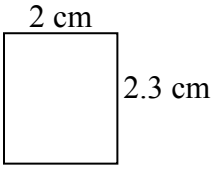

1 cm = 8 ft

4)

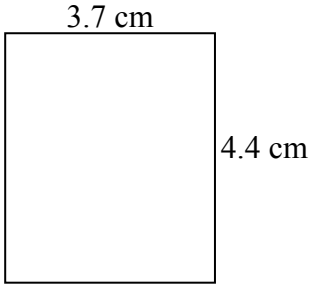

1 cm = 2 ft

5)

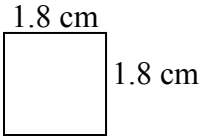

1 cm = 4 ft

6)

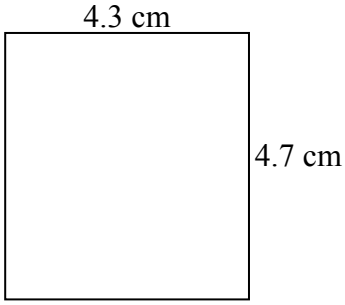

1 cm = 2 ft

7)

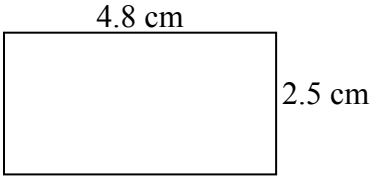

1 cm = 7 ft

8)

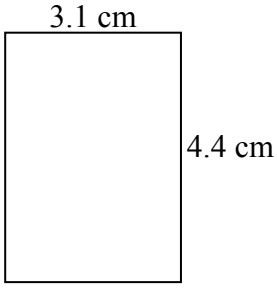

1 cm = 5 ft

Ответы

1.	17.5	6.5	114
2.	33.6	12.8	430
3.	16	18.4	294
4.	7.4	8.8	65
5.	7.2	7.2	52
6.	8.6	9.4	81
7.	33.6	17.5	588
8.	15.5	22	341

1-8	88	75	63	50	38	25	13	0