Определение периметра Имя:

Определите периметр закрашенной фигуры. Каждый блок равен 1 единице (u).

1)

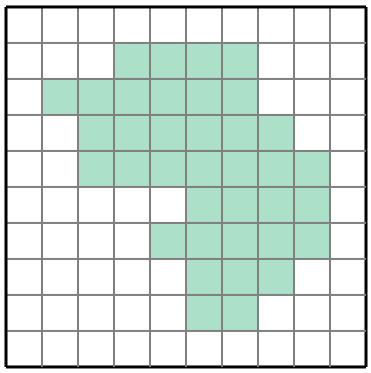

2)

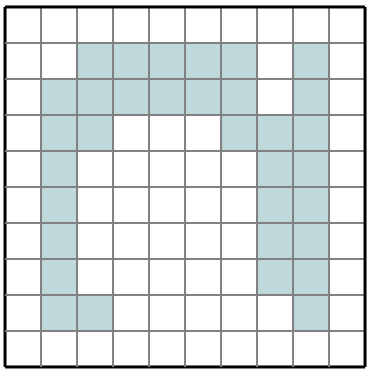

3)

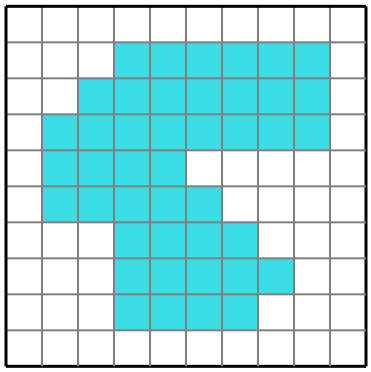

4)

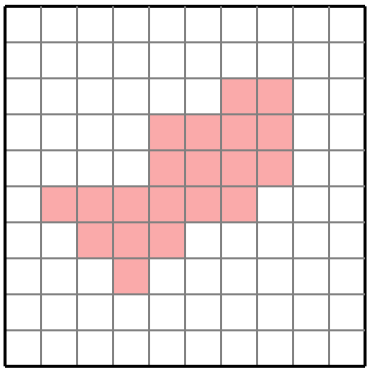

5)

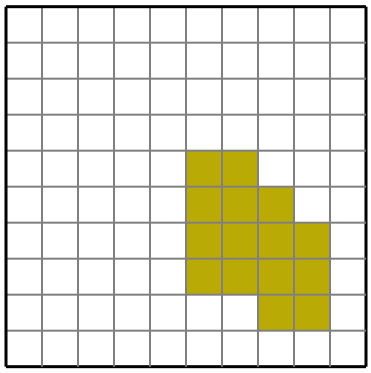

6)

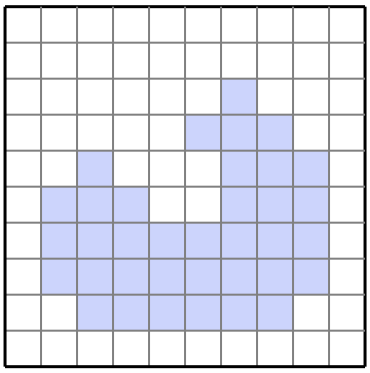

7)

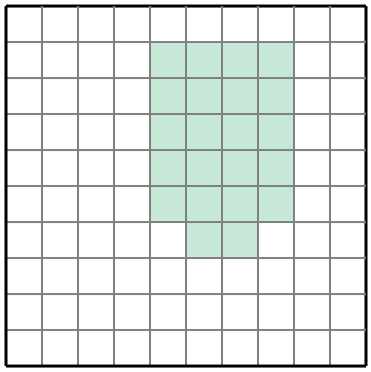

8)

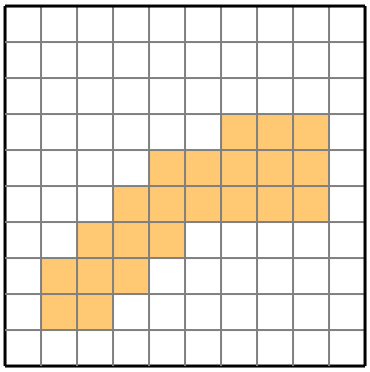

Ответы

1. _____
2. _____
3. _____
4. _____
5. _____
6. _____
7. _____
8. _____

1-8	88	75	63	50	38	25	13	0

Определите периметр закрашенной фигуры. Каждый блок равен 1 единице (u).

1)

			2	1	1	2			
	3	1				1			
		1					2		
		2	1	1				2	
					1			1	
				3				2	
					1		2		
					2	2			

2)

		2	1	1	1	2		3	
	2		1	1	1	1		2	
	1	2				2	1	1	
	2						1	1	
	2						1	1	
	2						1	1	
	2						2	1	
	2	3						3	

3)

			2	1	1	1	1	2	
		2						1	
	2				1	1	1	2	
	1			1					
	2	1			2				
			1			2			
			1				3		
			2	1	1	2			

4)

						2	2		
				2	1		1		
				1			2		
	3	1	1		1	2			
		2		2					
			3						

5)

					2	2			
					1		2		
					1			2	
					2	1		1	
							2	2	

6)

						3			
					3		2		
		3				1		2	
	2		2			1		1	
	1			1	1			1	
	2							2	
		2	1	1	1	1	2		

7)

				2	1	1	2		
				1			1		
				1			1		
				1			1		
				2			2		
					2	2			

8)

						2	1	2	
				2	1			1	
			2		1	1	1	2	
		2		2					
	2		2						
	2	2							

Ответы

1. 34
2. 50
3. 38
4. 26
5. 18
6. 36
7. 20
8. 28

1-8	88	75	63	50	38	25	13	0