Определение значения дроби по блокам Имя:

Используйте блок слева для нахождения значения наборов блоков справа.

1)

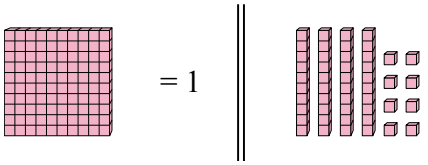

2)

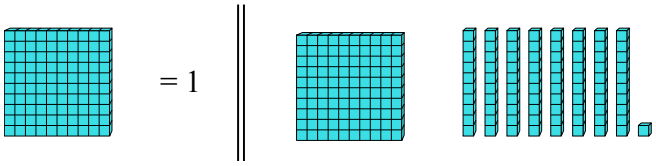

3)

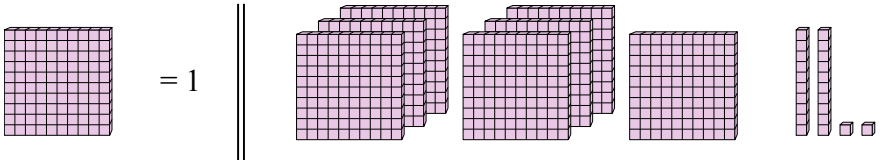

4)

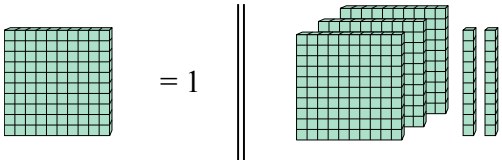

5)

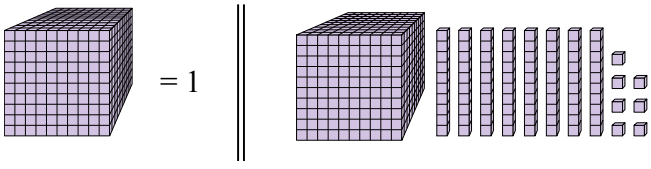

6)

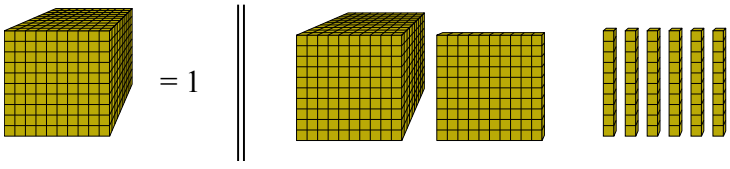

7)

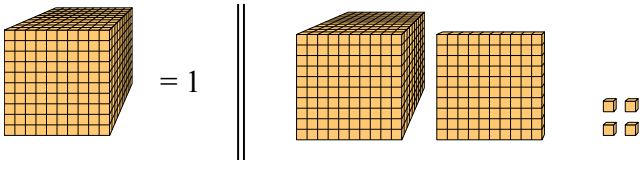

8)

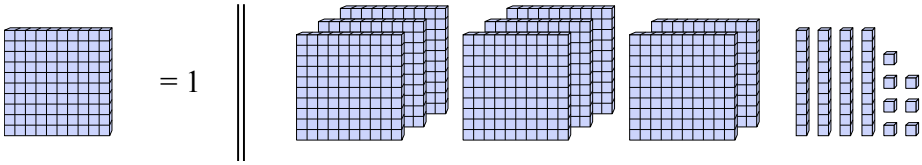

9)



10)

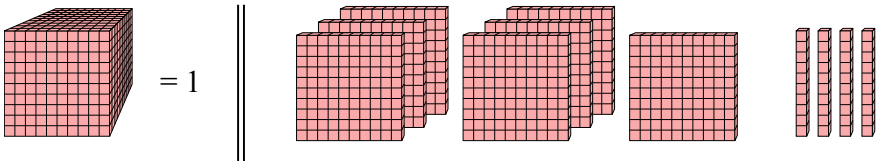

Ответы

1. _____
2. _____
3. _____
4. _____
5. _____
6. _____
7. _____
8. _____
9. _____
10. _____

1-10	90	80	70	60	50	40	30	20	10	0

Определение значения дроби по блокам Имя: Ключ к правильным ответам

Используйте блок слева для нахождения значения наборов блоков справа.

1) 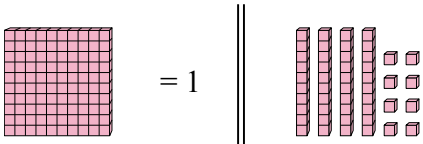

2) 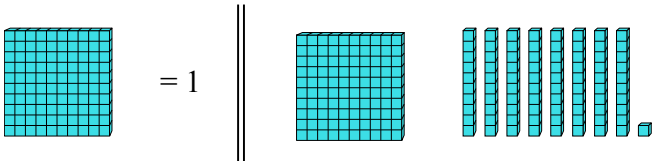

3) 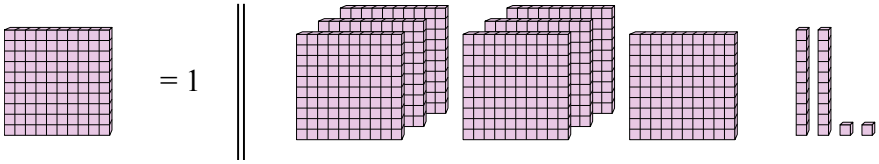

4) 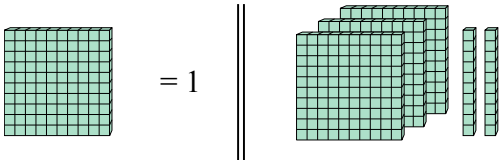

5) 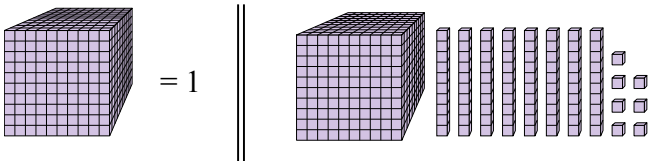

6) 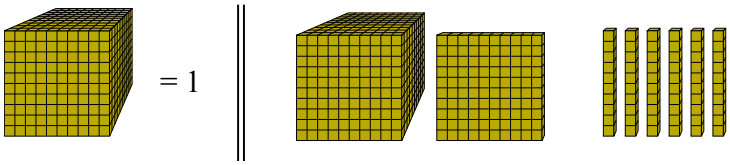

7) 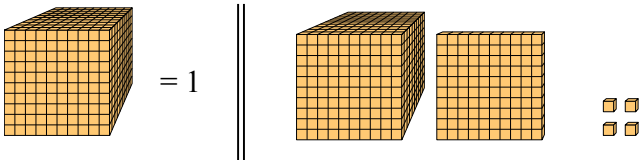

8) 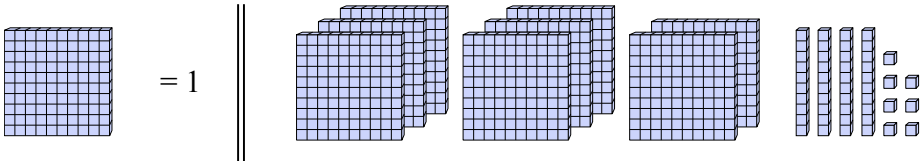

9) 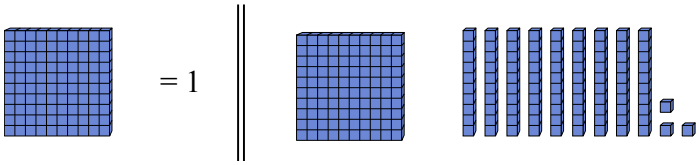

10) 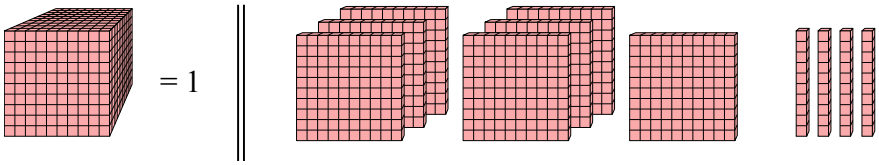

Ответы

1. **0,48**
2. **1,81**
3. **7,22**
4. **3,2**
5. **1,087**
6. **1,16**
7. **1,104**
8. **8,47**
9. **1,93**
10. **0,74**

1-10	90	80	70	60	50	40	30	20	10	0