Нахождение дроби(визуальное) Имя:

Определите под какой буквой находятся соответствующие дроби.

1)

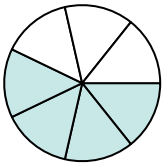

$\frac{4}{7}$

2)

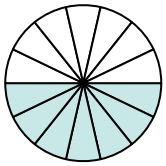

$\frac{7}{14}$

3)

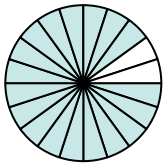

$\frac{18}{20}$

4)

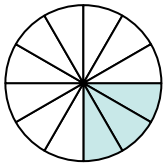

$\frac{3}{12}$

5)

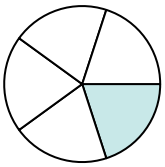

$\frac{1}{5}$

6)

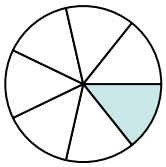

$\frac{1}{7}$

7)

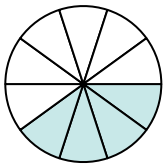

$\frac{4}{10}$

8)

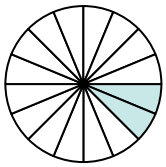

$\frac{2}{16}$

9)

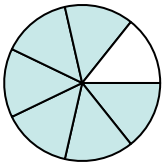

$\frac{6}{7}$

10)

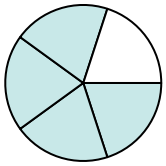

$\frac{4}{5}$

11)

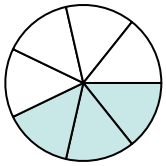

$\frac{3}{7}$

12)

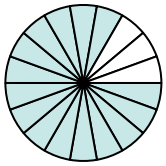

$\frac{15}{18}$

A.

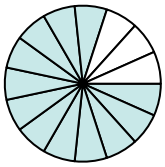

$\frac{12}{15}$

B.

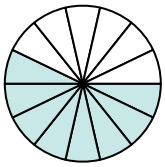

$\frac{8}{14}$

C.

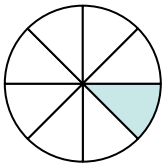

$\frac{1}{8}$

D.

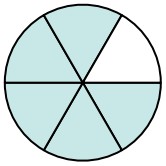

$\frac{5}{6}$

E.

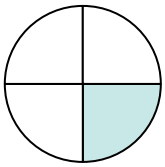

$\frac{1}{4}$

F.

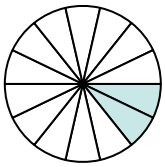

$\frac{2}{14}$

G.

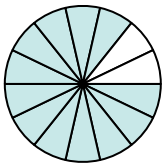

$\frac{12}{14}$

H.

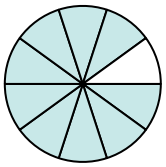

$\frac{9}{10}$

I.

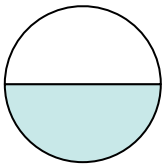

$\frac{1}{2}$

J.

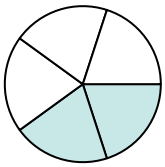

$\frac{2}{5}$

K.



$\frac{4}{20}$

L.

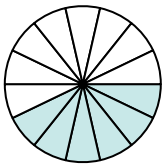

$\frac{6}{14}$

Ответы

1. _____
2. _____
3. _____
4. _____
5. _____
6. _____
7. _____
8. _____
9. _____
10. _____
11. _____
12. _____

1-10	92	83	75	67	58	50	42	33	25	17
11-12	8	0								

Нахождение дроби(визуальное) Имя: Ключ к правильным ответам

Определите под какой буквой находятся соответствующие дроби.

1)

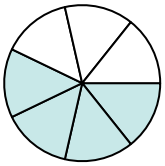

$\frac{4}{7}$

2)

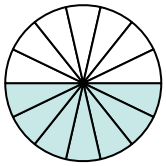

$\frac{7}{14}$

3)

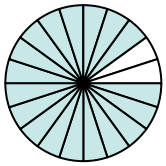

$\frac{18}{20}$

4)

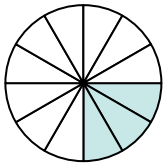

$\frac{3}{12}$

5)

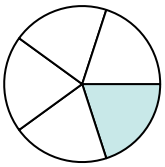

$\frac{1}{5}$

6)

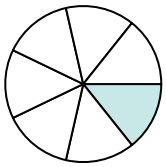

$\frac{1}{7}$

7)

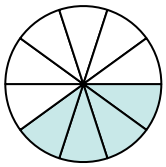

$\frac{4}{10}$

8)

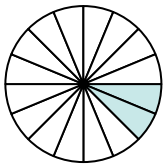

$\frac{2}{16}$

9)

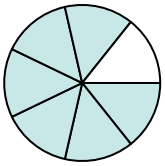

$\frac{6}{7}$

10)

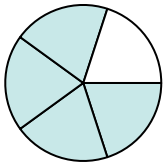

$\frac{4}{5}$

11)

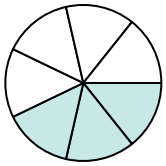

$\frac{3}{7}$

12)

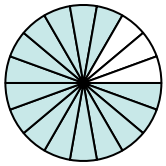

$\frac{15}{18}$

A.

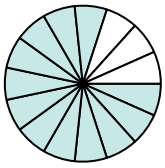

$\frac{12}{15}$

B.

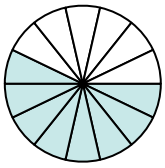

$\frac{8}{14}$

C.

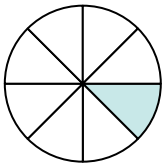

$\frac{1}{8}$

D.

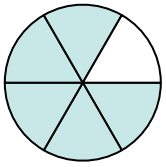

$\frac{5}{6}$

E.

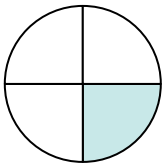

$\frac{1}{4}$

F.

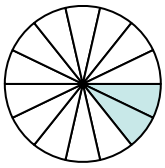

$\frac{2}{14}$

G.

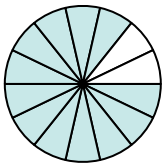

$\frac{12}{14}$

H.

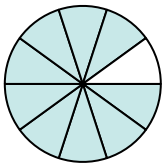

$\frac{9}{10}$

I.

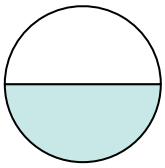

$\frac{1}{2}$

J.

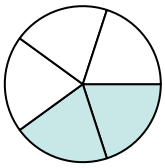

$\frac{2}{5}$

K.

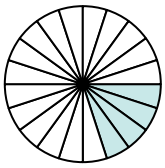

$\frac{4}{20}$

L.

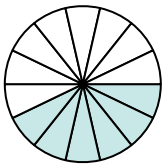

$\frac{6}{14}$

Ответы

1. B
2. I
3. H
4. E
5. K
6. F
7. J
8. C
9. G
10. A
11. L
12. D

1-10	92	83	75	67	58	50	42	33	25	17
11-12	8	0								

Нахождение дроби(визуальное) Имя:

Определите под какой буквой находятся соответствующие дроби.

1)

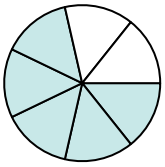

$\frac{5}{7}$

2)

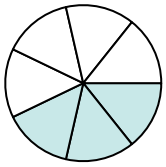

$\frac{3}{7}$

3)

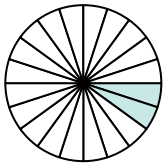

$\frac{2}{20}$

4)

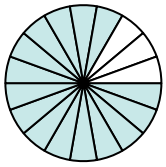

$\frac{15}{18}$

5)

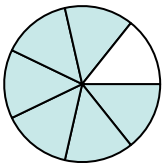

$\frac{6}{7}$

6)



$\frac{12}{20}$

7)

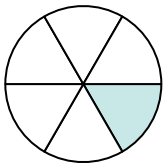

$\frac{1}{6}$

8)

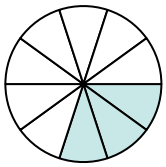

$\frac{3}{10}$

9)

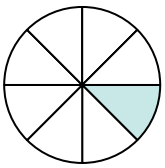

$\frac{1}{8}$

10)

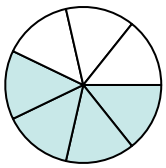

$\frac{4}{7}$

11)

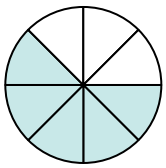

$\frac{5}{8}$

12)



$\frac{4}{20}$

A.

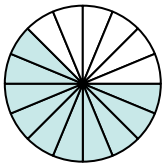

$\frac{10}{16}$

B.

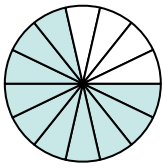

$\frac{10}{14}$

C.

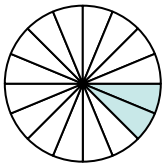

$\frac{2}{16}$

D.

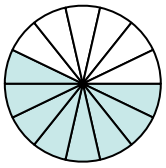

$\frac{8}{14}$

E.

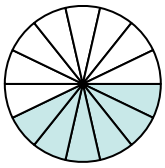

$\frac{6}{14}$

F.

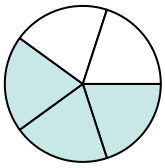

$\frac{3}{5}$

G.

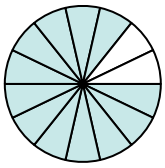

$\frac{12}{14}$

H.

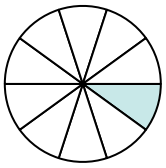

$\frac{1}{10}$

I.

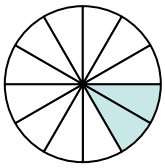

$\frac{2}{12}$

J.

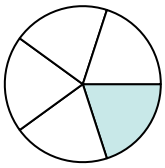

$\frac{1}{5}$

K.

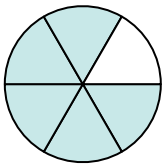

$\frac{5}{6}$

L.



$\frac{6}{20}$

Ответы

1. _____
2. _____
3. _____
4. _____
5. _____
6. _____
7. _____
8. _____
9. _____
10. _____
11. _____
12. _____

1-10	92	83	75	67	58	50	42	33	25	17
11-12	8	0								

Нахождение дроби(визуальное) Имя: Ключ к правильным ответам

Определите под какой буквой находятся соответствующие дроби.

1)

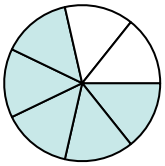

$\frac{5}{7}$

2)

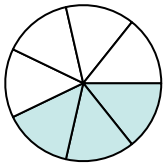

$\frac{3}{7}$

3)

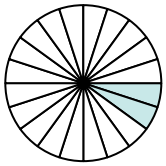

$\frac{2}{20}$

4)

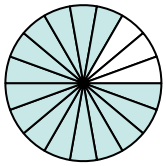

$\frac{15}{18}$

5)

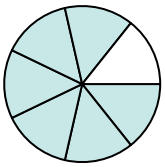

$\frac{6}{7}$

6)



$\frac{12}{20}$

7)

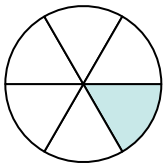

$\frac{1}{6}$

8)

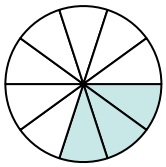

$\frac{3}{10}$

9)

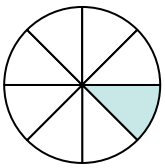

$\frac{1}{8}$

10)

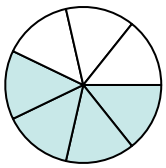

$\frac{4}{7}$

11)

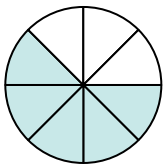

$\frac{5}{8}$

12)



$\frac{4}{20}$

A.

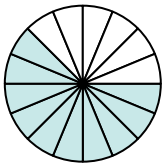

$\frac{10}{16}$

B.

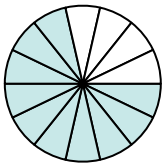

$\frac{10}{14}$

C.

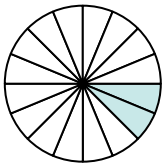

$\frac{2}{16}$

D.

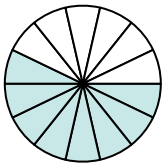

$\frac{8}{14}$

E.

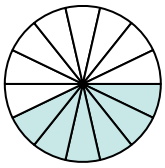

$\frac{6}{14}$

F.

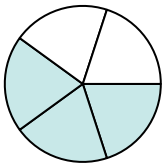

$\frac{3}{5}$

G.

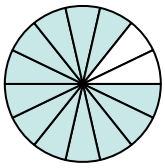

$\frac{12}{14}$

H.

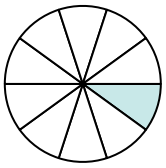

$\frac{1}{10}$

I.

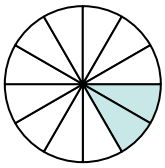

$\frac{2}{12}$

J.

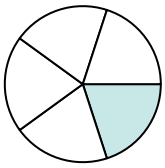

$\frac{1}{5}$

K.

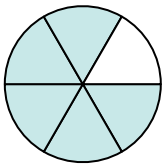

$\frac{5}{6}$

L.



$\frac{6}{20}$

Ответы

1. B
2. E
3. H
4. K
5. G
6. F
7. I
8. L
9. C
10. D
11. A
12. J

1-10	92	83	75	67	58	50	42	33	25	17
11-12	8	0								

Нахождение дроби(визуальное) Имя:

Определите под какой буквой находятся соответствующие дроби.

1)

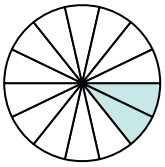

$\frac{2}{14}$

2)

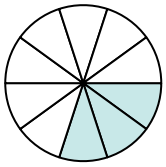

$\frac{3}{10}$

3)

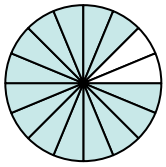

$\frac{14}{16}$

4)

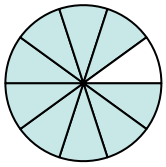

$\frac{9}{10}$

5)

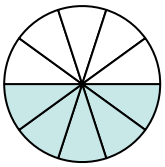

$\frac{5}{10}$

6)

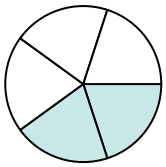

$\frac{2}{5}$

7)

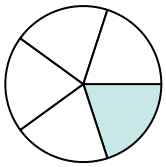

$\frac{1}{5}$

8)

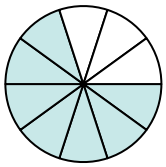

$\frac{7}{10}$

9)

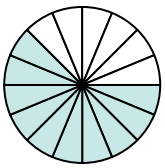

$\frac{10}{16}$

10)

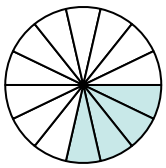

$\frac{4}{14}$

11)

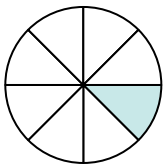

$\frac{1}{8}$

12)

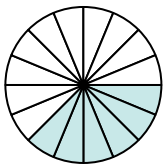

$\frac{6}{16}$

A.

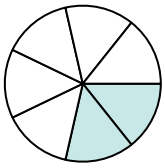

$\frac{2}{7}$

B.

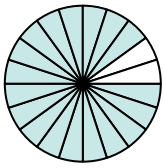

$\frac{18}{20}$

C.

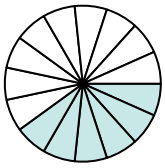

$\frac{6}{15}$

D.



$\frac{10}{20}$

E.

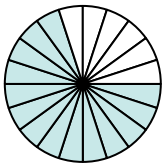

$\frac{14}{20}$

F.

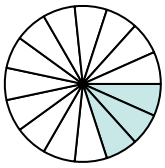

$\frac{3}{15}$

G.

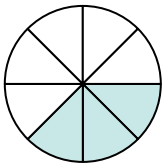

$\frac{3}{8}$

H.

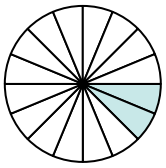

$\frac{2}{16}$

I.



$\frac{6}{20}$

J.

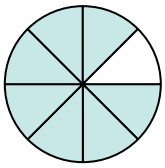

$\frac{7}{8}$

K.

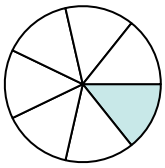

$\frac{1}{7}$

L.

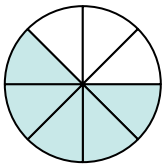

$\frac{5}{8}$

Ответы

1. _____
2. _____
3. _____
4. _____
5. _____
6. _____
7. _____
8. _____
9. _____
10. _____
11. _____
12. _____

1-10	92	83	75	67	58	50	42	33	25	17
11-12	8	0								

Нахождение дроби(визуальное) Имя: Ключ к правильным ответам

Определите под какой буквой находятся соответствующие дроби.

1)

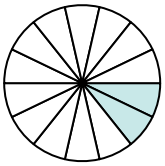

$\frac{2}{14}$

2)

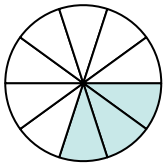

$\frac{3}{10}$

3)

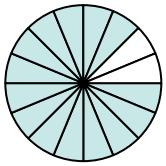

$\frac{14}{16}$

4)

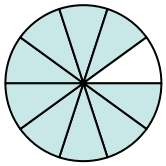

$\frac{9}{10}$

5)

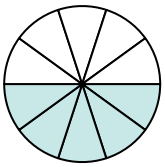

$\frac{5}{10}$

6)

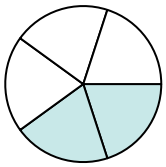

$\frac{2}{5}$

7)

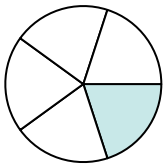

$\frac{1}{5}$

8)

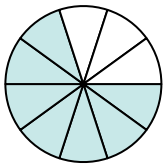

$\frac{7}{10}$

9)

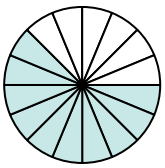

$\frac{10}{16}$

10)

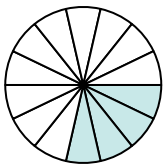

$\frac{4}{14}$

11)

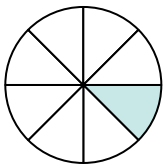

$\frac{1}{8}$

12)

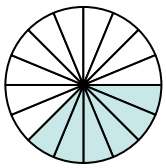

$\frac{6}{16}$

A.

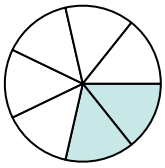

$\frac{2}{7}$

B.

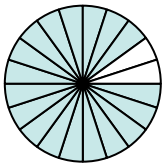

$\frac{18}{20}$

C.

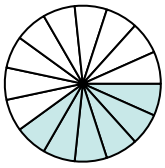

$\frac{6}{15}$

D.



$\frac{10}{20}$

E.

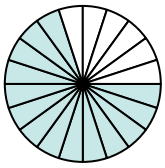

$\frac{14}{20}$

F.

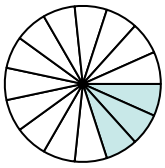

$\frac{3}{15}$

G.

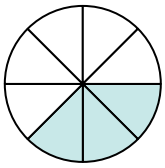

$\frac{3}{8}$

H.

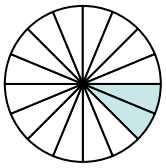

$\frac{2}{16}$

I.



$\frac{6}{20}$

J.

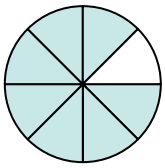

$\frac{7}{8}$

K.

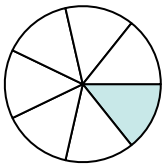

$\frac{1}{7}$

L.

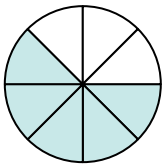

$\frac{5}{8}$

Ответы

1. K
2. I
3. J
4. B
5. D
6. C
7. F
8. E
9. L
10. A
11. H
12. G

1-10	92	83	75	67	58	50	42	33	25	17
11-12	8	0								

Нахождение дроби(визуальное) Имя:

Определите под какой буквой находятся соответствующие дроби.

1)

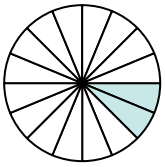

$\frac{2}{16}$

2)

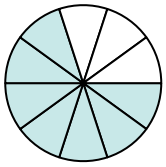

$\frac{7}{10}$

3)

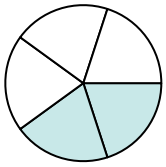

$\frac{2}{5}$

4)

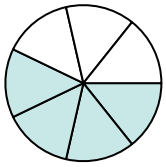

$\frac{4}{7}$

5)

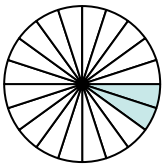

$\frac{2}{20}$

6)

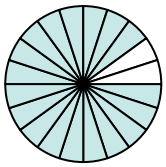

$\frac{18}{20}$

7)

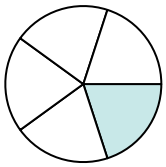

$\frac{1}{5}$

8)

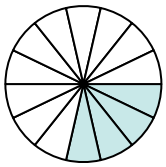

$\frac{4}{14}$

9)

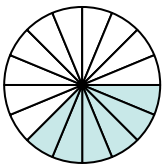

$\frac{6}{16}$

10)

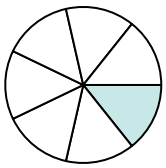

$\frac{1}{7}$

11)

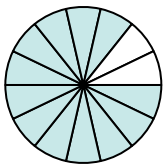

$\frac{12}{14}$

12)

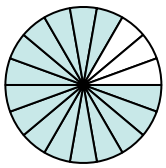

$\frac{15}{18}$

A.

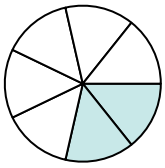

$\frac{2}{7}$

B.

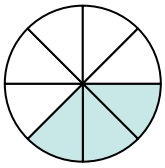

$\frac{3}{8}$

C.

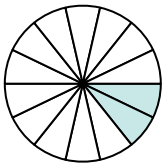

$\frac{2}{14}$

D.

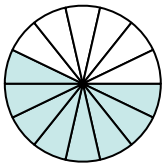

$\frac{8}{14}$

E.

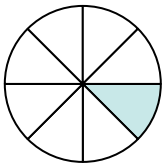

$\frac{1}{8}$

F.

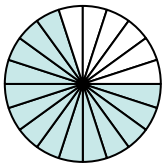

$\frac{14}{20}$

G.

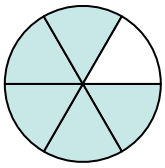

$\frac{5}{6}$

H.

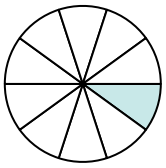

$\frac{1}{10}$

I.



$\frac{8}{20}$

J.

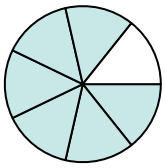

$\frac{6}{7}$

K.

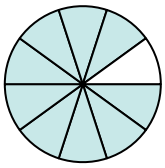

$\frac{9}{10}$

L.

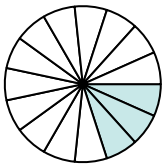

$\frac{3}{15}$

Ответы

1. _____
2. _____
3. _____
4. _____
5. _____
6. _____
7. _____
8. _____
9. _____
10. _____
11. _____
12. _____

1-10	92	83	75	67	58	50	42	33	25	17
11-12	8	0								

Нахождение дроби(визуальное) Имя: Ключ к правильным ответам

Определите под какой буквой находятся соответствующие дроби.

1)

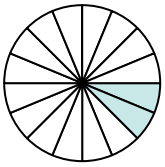

$\frac{2}{16}$

2)

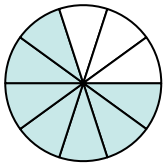

$\frac{7}{10}$

3)

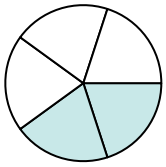

$\frac{2}{5}$

4)

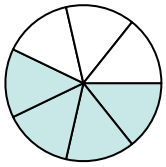

$\frac{4}{7}$

5)

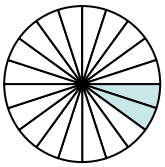

$\frac{2}{20}$

6)

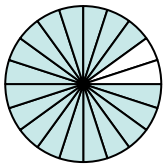

$\frac{18}{20}$

7)

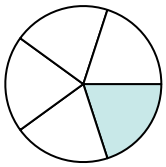

$\frac{1}{5}$

8)

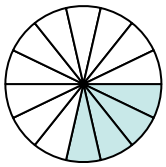

$\frac{4}{14}$

9)

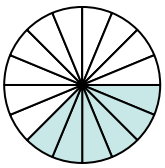

$\frac{6}{16}$

10)

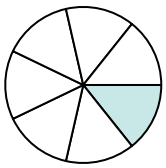

$\frac{1}{7}$

11)

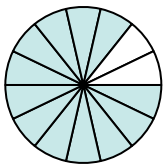

$\frac{12}{14}$

12)

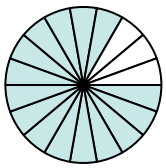

$\frac{15}{18}$

A.

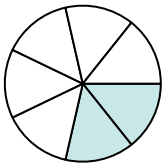

$\frac{2}{7}$

B.

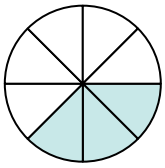

$\frac{3}{8}$

C.

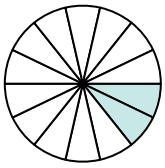

$\frac{2}{14}$

D.

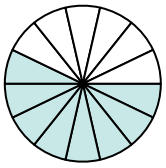

$\frac{8}{14}$

E.

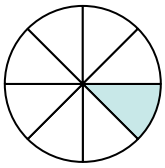

$\frac{1}{8}$

F.

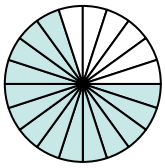

$\frac{14}{20}$

G.

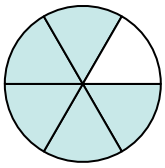

$\frac{5}{6}$

H.

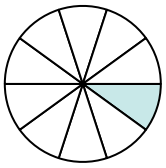

$\frac{1}{10}$

I.



$\frac{8}{20}$

J.

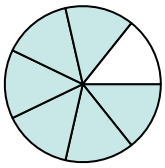

$\frac{6}{7}$

K.

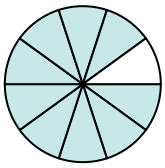

$\frac{9}{10}$

L.

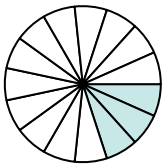

$\frac{3}{15}$

Ответы

1. E
2. F
3. I
4. D
5. H
6. K
7. L
8. A
9. B
10. C
11. J
12. G

1-10	92	83	75	67	58	50	42	33	25	17
11-12	8	0								

Нахождение дроби(визуальное) Имя:

Определите под какой буквой находятся соответствующие дроби.

1)

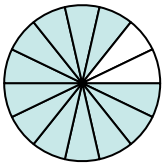

$\frac{12}{14}$

2)

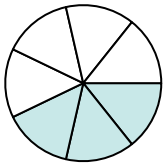

$\frac{3}{7}$

3)

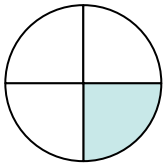

$\frac{1}{4}$

4)

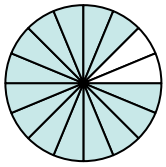

$\frac{14}{16}$

5)



$\frac{6}{20}$

6)

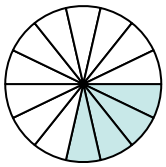

$\frac{4}{14}$

7)



$\frac{10}{20}$

8)

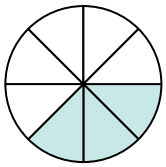

$\frac{3}{8}$

9)

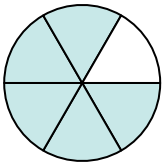

$\frac{5}{6}$

10)

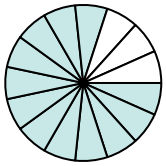

$\frac{12}{15}$

11)

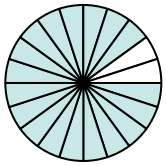

$\frac{18}{20}$

12)

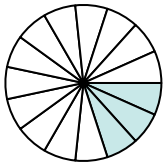

$\frac{3}{15}$

A.

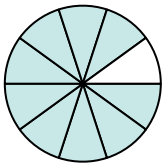

$\frac{9}{10}$

B.

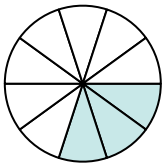

$\frac{3}{10}$

C.

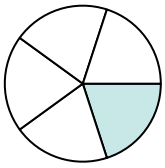

$\frac{1}{5}$

D.

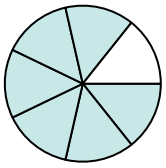

$\frac{6}{7}$

E.

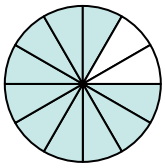

$\frac{10}{12}$

F.

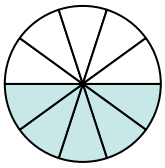

$\frac{5}{10}$

G.

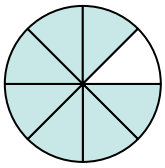

$\frac{7}{8}$

H.

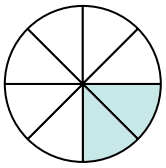

$\frac{2}{8}$

I.

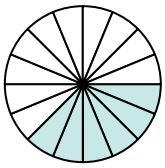

$\frac{6}{16}$

J.

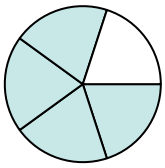

$\frac{4}{5}$

K.

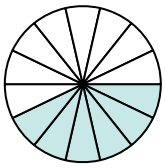

$\frac{6}{14}$

L.

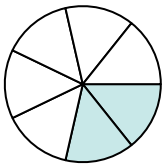

$\frac{2}{7}$

Ответы

1. _____
2. _____
3. _____
4. _____
5. _____
6. _____
7. _____
8. _____
9. _____
10. _____
11. _____
12. _____

1-10	92	83	75	67	58	50	42	33	25	17
11-12	8	0								

Нахождение дроби(визуальное) Имя: Ключ к правильным ответам

Определите под какой буквой находятся соответствующие дроби.

1)

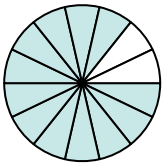

$\frac{12}{14}$

2)

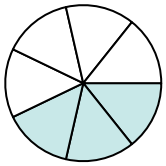

$\frac{3}{7}$

3)

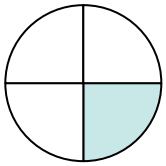

$\frac{1}{4}$

4)

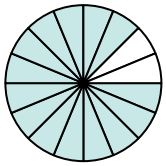

$\frac{14}{16}$

5)



$\frac{6}{20}$

6)

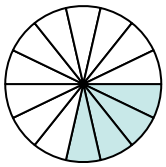

$\frac{4}{14}$

7)



$\frac{10}{20}$

8)

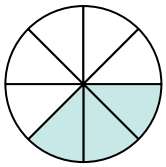

$\frac{3}{8}$

9)

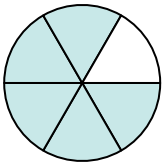

$\frac{5}{6}$

10)

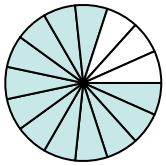

$\frac{12}{15}$

11)

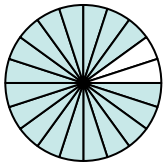

$\frac{18}{20}$

12)

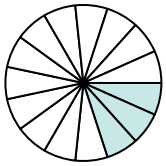

$\frac{3}{15}$

A.

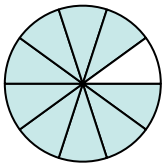

$\frac{9}{10}$

B.

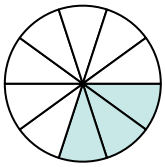

$\frac{3}{10}$

C.

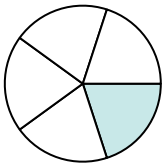

$\frac{1}{5}$

D.

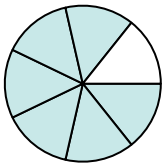

$\frac{6}{7}$

E.

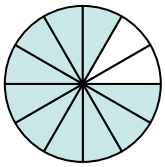

$\frac{10}{12}$

F.

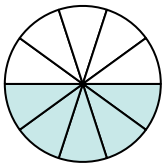

$\frac{5}{10}$

G.

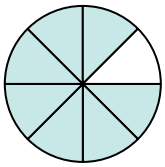

$\frac{7}{8}$

H.

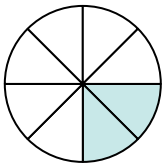

$\frac{2}{8}$

I.

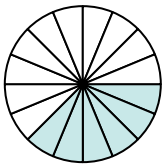

$\frac{6}{16}$

J.

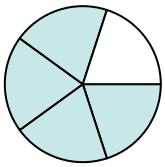

$\frac{4}{5}$

K.

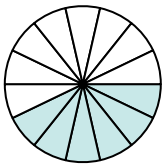

$\frac{6}{14}$

L.

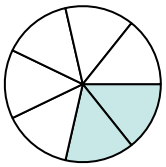

$\frac{2}{7}$

Ответы

1. D
2. K
3. H
4. G
5. B
6. L
7. F
8. I
9. E
10. J
11. A
12. C

1-10	92	83	75	67	58	50	42	33	25	17
11-12	8	0								

Нахождение дроби(визуальное) Имя:

Определите под какой буквой находятся соответствующие дроби.

1)

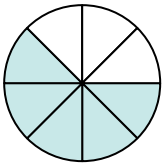

$\frac{5}{8}$

2)

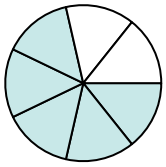

$\frac{5}{7}$

3)

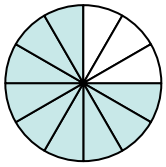

$\frac{9}{12}$

4)



$\frac{6}{20}$

5)

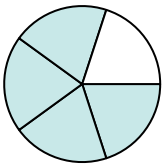

$\frac{4}{5}$

6)

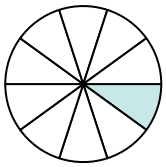

$\frac{1}{10}$

7)

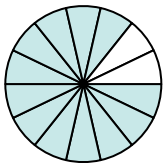

$\frac{12}{14}$

8)



$\frac{8}{20}$

9)

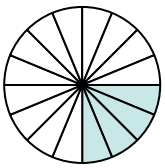

$\frac{4}{16}$

10)

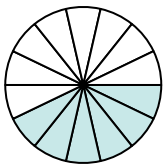

$\frac{6}{14}$

11)

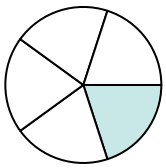

$\frac{1}{5}$

12)

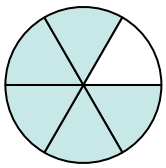

$\frac{5}{6}$

A.

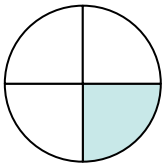

$\frac{1}{4}$

B.

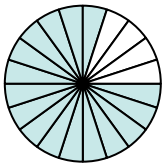

$\frac{16}{20}$

C.

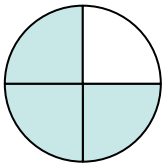

$\frac{3}{4}$

D.

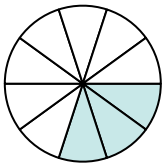

$\frac{3}{10}$

E.

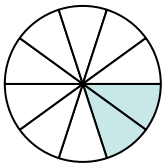

$\frac{2}{10}$

F.

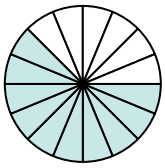

$\frac{10}{16}$

G.

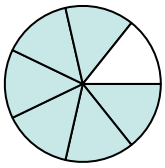

$\frac{6}{7}$

H.

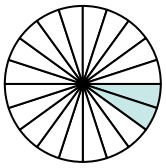

$\frac{2}{20}$

I.

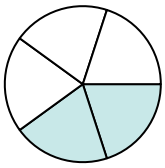

$\frac{2}{5}$

J.

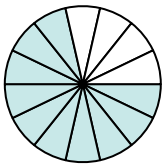

$\frac{10}{14}$

K.

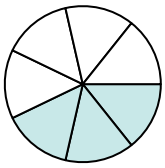

$\frac{3}{7}$

L.

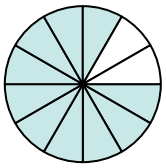

$\frac{10}{12}$

Ответы

1. _____
2. _____
3. _____
4. _____
5. _____
6. _____
7. _____
8. _____
9. _____
10. _____
11. _____
12. _____

1-10	92	83	75	67	58	50	42	33	25	17
11-12	8	0								

Нахождение дроби(визуальное) Имя: Ключ к правильным ответам

Определите под какой буквой находятся соответствующие дроби.

1)

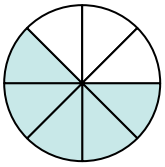

$\frac{5}{8}$

2)

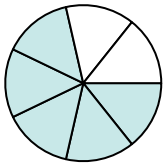

$\frac{5}{7}$

3)

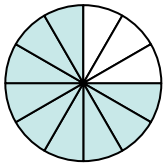

$\frac{9}{12}$

4)



$\frac{6}{20}$

5)

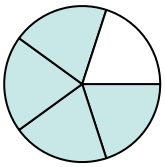

$\frac{4}{5}$

6)

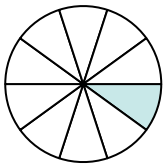

$\frac{1}{10}$

7)

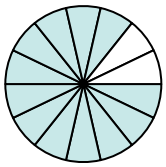

$\frac{12}{14}$

8)



$\frac{8}{20}$

9)

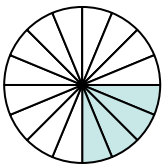

$\frac{4}{16}$

10)

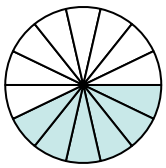

$\frac{6}{14}$

11)

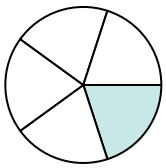

$\frac{1}{5}$

12)

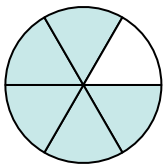

$\frac{5}{6}$

A.

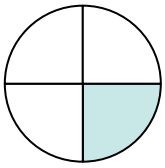

$\frac{1}{4}$

B.

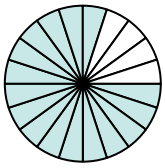

$\frac{16}{20}$

C.

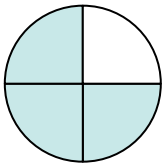

$\frac{3}{4}$

D.

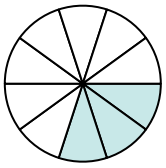

$\frac{3}{10}$

E.

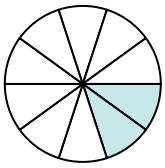

$\frac{2}{10}$

F.

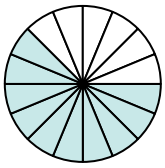

$\frac{10}{16}$

G.

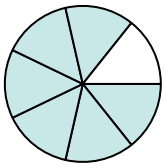

$\frac{6}{7}$

H.

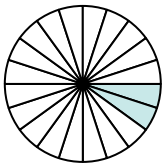

$\frac{2}{20}$

I.

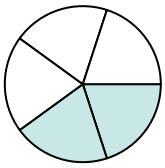

$\frac{2}{5}$

J.

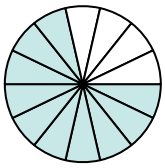

$\frac{10}{14}$

K.

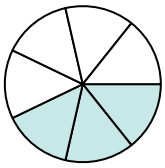

$\frac{3}{7}$

L.

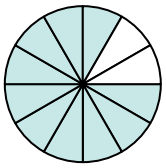

$\frac{10}{12}$

Ответы

1. F
2. J
3. C
4. D
5. B
6. H
7. G
8. I
9. A
10. K
11. E
12. L

1-10	92	83	75	67	58	50	42	33	25	17
11-12	8	0								

Нахождение дроби(визуальное) Имя:

Определите под какой буквой находятся соответствующие дроби.

1)

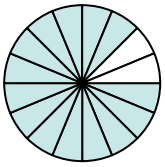

$\frac{14}{16}$

2)

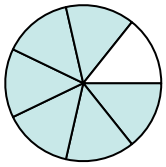

$\frac{6}{7}$

3)

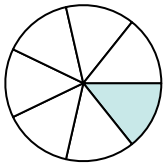

$\frac{1}{7}$

4)

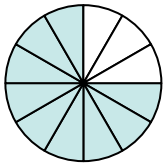

$\frac{9}{12}$

5)

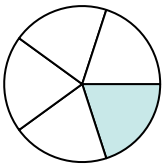

$\frac{1}{5}$

6)

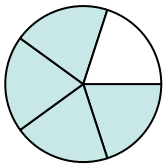

$\frac{4}{5}$

7)

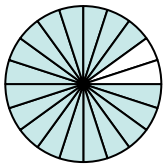

$\frac{18}{20}$

8)

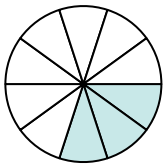

$\frac{3}{10}$

9)

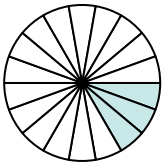

$\frac{3}{18}$

10)

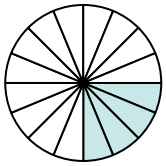

$\frac{4}{16}$

11)

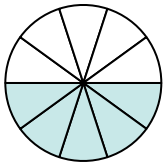

$\frac{5}{10}$

12)

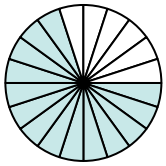

$\frac{14}{20}$

A.

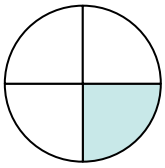

$\frac{1}{4}$

B.

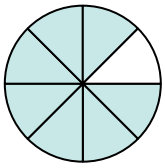

$\frac{7}{8}$

C.

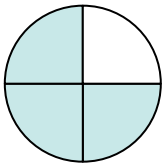

$\frac{3}{4}$

D.

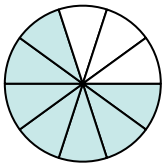

$\frac{7}{10}$

E.

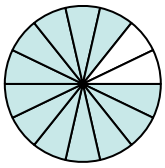

$\frac{12}{14}$

F.

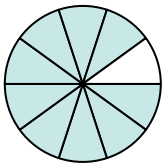

$\frac{9}{10}$

G.

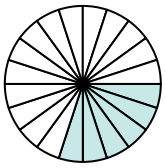

$\frac{6}{20}$

H.



$\frac{10}{20}$

I.

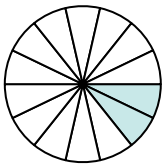

$\frac{2}{14}$

J.

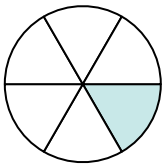

$\frac{1}{6}$

K.

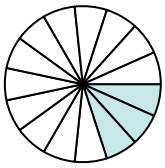

$\frac{3}{15}$

L.

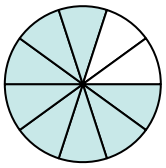

$\frac{8}{10}$

Ответы

1. _____
2. _____
3. _____
4. _____
5. _____
6. _____
7. _____
8. _____
9. _____
10. _____
11. _____
12. _____

1-10	92	83	75	67	58	50	42	33	25	17
11-12	8	0								

Нахождение дроби(визуальное) Имя: Ключ к правильным ответам

Определите под какой буквой находятся соответствующие дроби.

1) 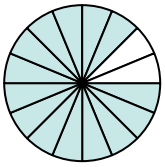

$\frac{14}{16}$

2) 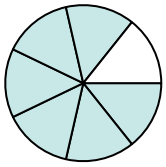

$\frac{6}{7}$

3) 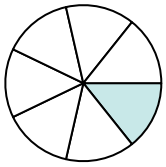

$\frac{1}{7}$

4) 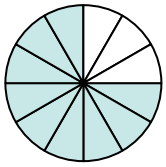

$\frac{9}{12}$

5) 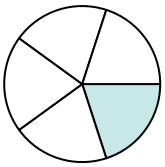

$\frac{1}{5}$

6) 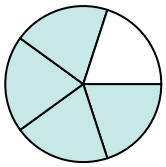

$\frac{4}{5}$

7) 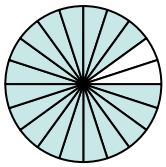

$\frac{18}{20}$

8) 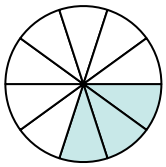

$\frac{3}{10}$

9) 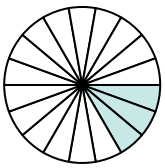

$\frac{3}{18}$

10) 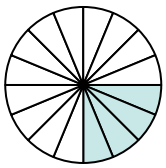

$\frac{4}{16}$

11) 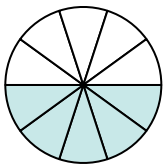

$\frac{5}{10}$

12) 

$\frac{14}{20}$

A. 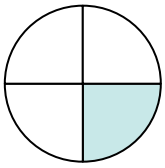

$\frac{1}{4}$

B. 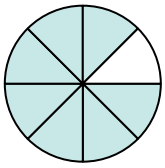

$\frac{7}{8}$

C. 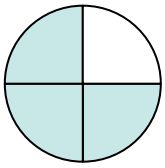

$\frac{3}{4}$

D. 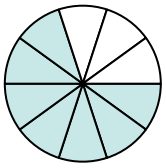

$\frac{7}{10}$

E. 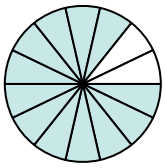

$\frac{12}{14}$

F. 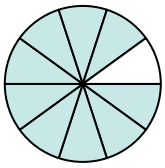

$\frac{9}{10}$

G. 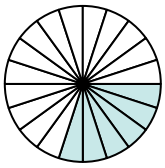

$\frac{6}{20}$

H. 

$\frac{10}{20}$

I. 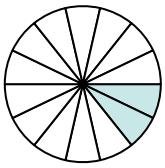

$\frac{2}{14}$

J. 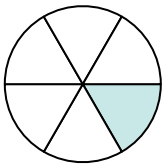

$\frac{1}{6}$

K. 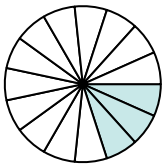

$\frac{3}{15}$

L. 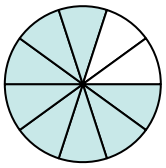

$\frac{8}{10}$

Ответы

1. B
2. E
3. I
4. C
5. K
6. L
7. F
8. G
9. J
10. A
11. H
12. D

1-10	92	83	75	67	58	50	42	33	25	17
11-12	8	0								

Нахождение дроби(визуальное) Имя:

Определите под какой буквой находятся соответствующие дроби.

1) 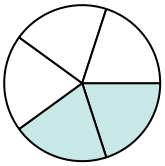

$\frac{2}{5}$

2) 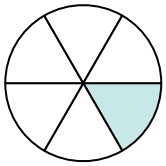

$\frac{1}{6}$

3) 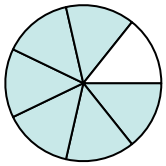

$\frac{6}{7}$

4) 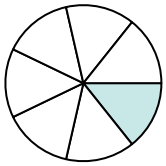

$\frac{1}{7}$

5) 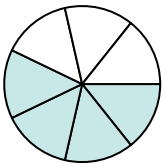

$\frac{4}{7}$

6) 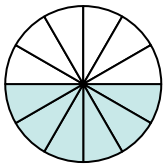

$\frac{6}{12}$

7) 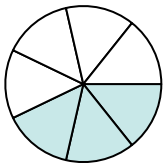

$\frac{3}{7}$

8) 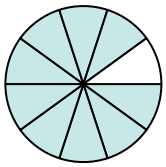

$\frac{9}{10}$

9) 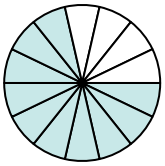

$\frac{10}{14}$

10) 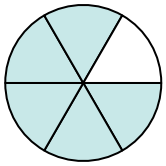

$\frac{5}{6}$

11) 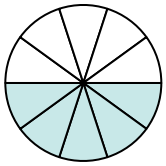

$\frac{5}{10}$

12) 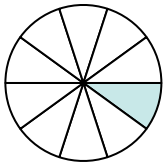

$\frac{1}{10}$

A. 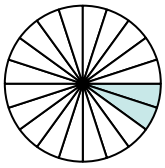

$\frac{2}{20}$

B. 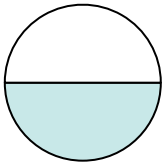

$\frac{1}{2}$

C. 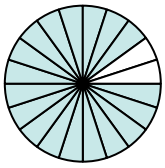

$\frac{18}{20}$

D. 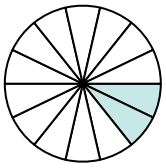

$\frac{2}{14}$

E. 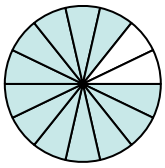

$\frac{12}{14}$

F. 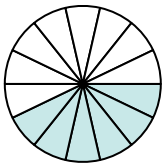

$\frac{6}{14}$

G. 

$\frac{10}{20}$

H. 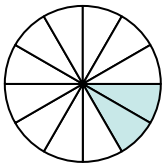

$\frac{2}{12}$

I. 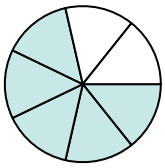

$\frac{5}{7}$

J. 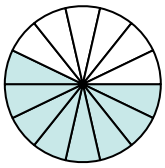

$\frac{8}{14}$

K. 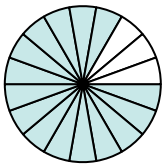

$\frac{15}{18}$

L. 

$\frac{8}{20}$

Ответы

1. _____
2. _____
3. _____
4. _____
5. _____
6. _____
7. _____
8. _____
9. _____
10. _____
11. _____
12. _____

1-10	92	83	75	67	58	50	42	33	25	17
11-12	8	0								

Нахождение дроби(визуальное) Имя: Ключ к правильным ответам

Определите под какой буквой находятся соответствующие дроби.

1) 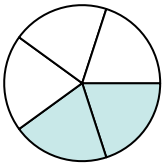

$\frac{2}{5}$

2) 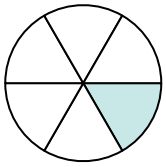

$\frac{1}{6}$

3) 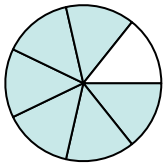

$\frac{6}{7}$

4) 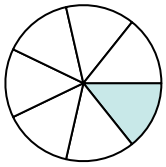

$\frac{1}{7}$

5) 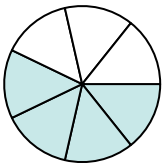

$\frac{4}{7}$

6) 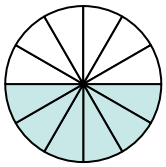

$\frac{6}{12}$

7) 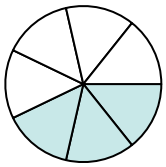

$\frac{3}{7}$

8) 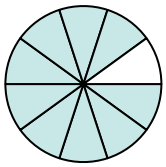

$\frac{9}{10}$

9) 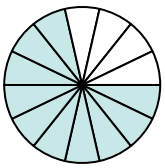

$\frac{10}{14}$

10) 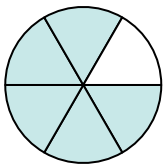

$\frac{5}{6}$

11) 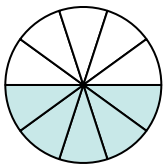

$\frac{5}{10}$

12) 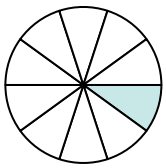

$\frac{1}{10}$

A. 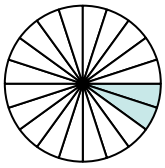

$\frac{2}{20}$

B. 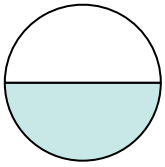

$\frac{1}{2}$

C. 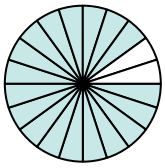

$\frac{18}{20}$

D. 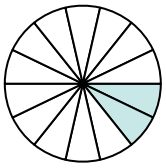

$\frac{2}{14}$

E. 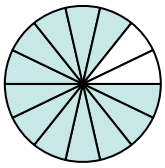

$\frac{12}{14}$

F. 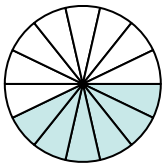

$\frac{6}{14}$

G. 

$\frac{10}{20}$

H. 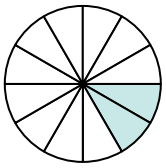

$\frac{2}{12}$

I. 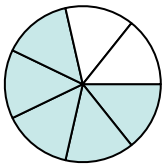

$\frac{5}{7}$

J. 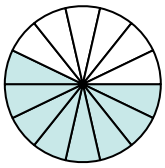

$\frac{8}{14}$

K. 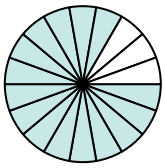

$\frac{15}{18}$

L. 

$\frac{8}{20}$

Ответы

1. L
2. H
3. E
4. D
5. J
6. B
7. F
8. C
9. I
10. K
11. G
12. A

1-10	92	83	75	67	58	50	42	33	25	17
11-12	8	0								

Нахождение дроби(визуальное) Имя:

Определите под какой буквой находятся соответствующие дроби.

1)



$\frac{6}{20}$

2)

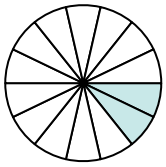

$\frac{2}{14}$

3)

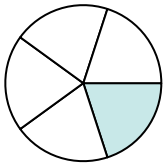

$\frac{1}{5}$

4)

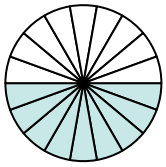

$\frac{9}{18}$

5)

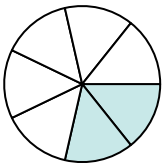

$\frac{2}{7}$

6)

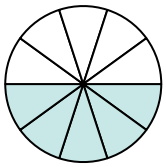

$\frac{5}{10}$

7)



$\frac{12}{20}$

8)

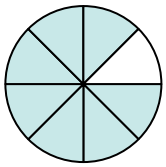

$\frac{7}{8}$

9)

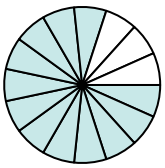

$\frac{12}{15}$

10)

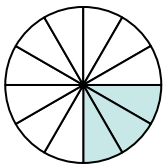

$\frac{3}{12}$

11)

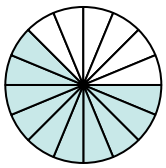

$\frac{10}{16}$

12)

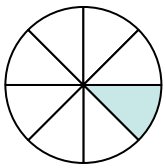

$\frac{1}{8}$

A.

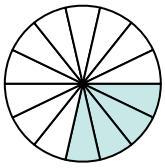

$\frac{4}{14}$

B.



$\frac{10}{20}$

C.

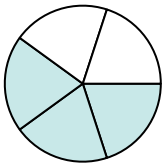

$\frac{3}{5}$

D.

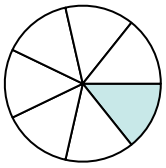

$\frac{1}{7}$

E.

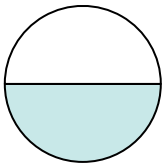

$\frac{1}{2}$

F.

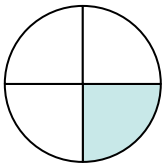

$\frac{1}{4}$

G.

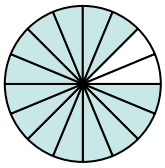

$\frac{14}{16}$

H.

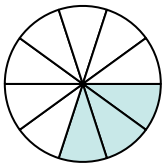

$\frac{3}{10}$

I.

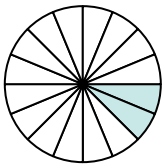

$\frac{2}{16}$

J.

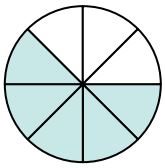

$\frac{5}{8}$

K.

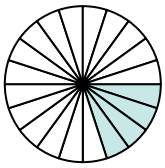

$\frac{4}{20}$

L.

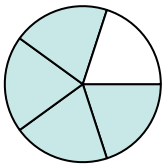

$\frac{4}{5}$

Ответы

1. _____
2. _____
3. _____
4. _____
5. _____
6. _____
7. _____
8. _____
9. _____
10. _____
11. _____
12. _____

1-10	92	83	75	67	58	50	42	33	25	17
11-12	8	0								

Нахождение дроби(визуальное) Имя: Ключ к правильным ответам

Определите под какой буквой находятся соответствующие дроби.

1)



$\frac{6}{20}$

2)

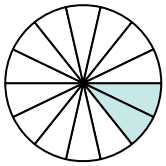

$\frac{2}{14}$

3)

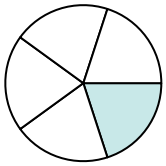

$\frac{1}{5}$

4)

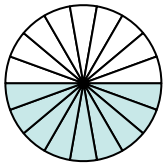

$\frac{9}{18}$

5)

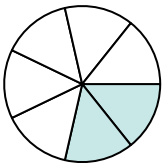

$\frac{2}{7}$

6)

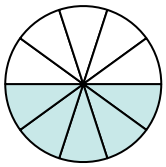

$\frac{5}{10}$

7)



$\frac{12}{20}$

8)

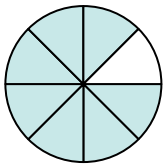

$\frac{7}{8}$

9)

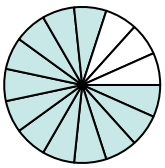

$\frac{12}{15}$

10)

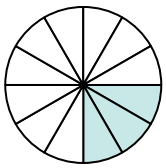

$\frac{3}{12}$

11)

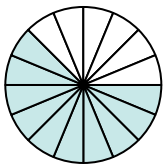

$\frac{10}{16}$

12)

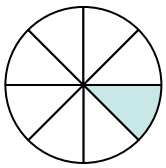

$\frac{1}{8}$

A.

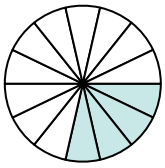

$\frac{4}{14}$

B.



$\frac{10}{20}$

C.

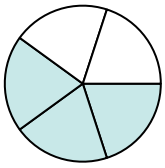

$\frac{3}{5}$

D.

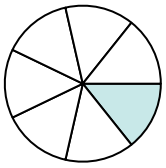

$\frac{1}{7}$

E.

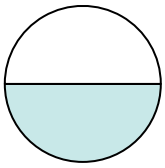

$\frac{1}{2}$

F.

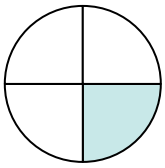

$\frac{1}{4}$

G.

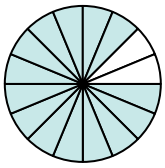

$\frac{14}{16}$

H.

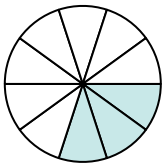

$\frac{3}{10}$

I.

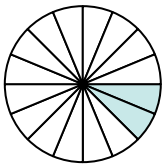

$\frac{2}{16}$

J.

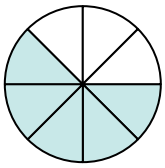

$\frac{5}{8}$

K.

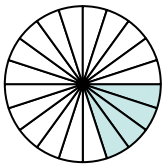

$\frac{4}{20}$

L.

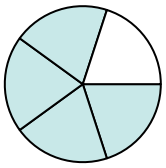

$\frac{4}{5}$

Ответы

1. H
2. D
3. K
4. E
5. A
6. B
7. C
8. G
9. L
10. F
11. J
12. I

1-10	92	83	75	67	58	50	42	33	25	17
11-12	8	0								

Нахождение дроби(визуальное) Имя:

Определите под какой буквой находятся соответствующие дроби.

1)

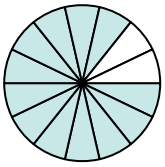

$\frac{12}{14}$

2)

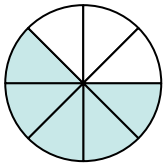

$\frac{5}{8}$

3)

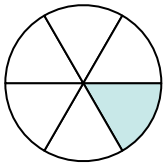

$\frac{1}{6}$

4)

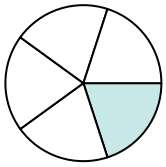

$\frac{1}{5}$

5)

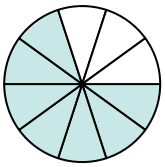

$\frac{7}{10}$

6)

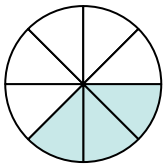

$\frac{3}{8}$

7)

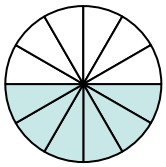

$\frac{6}{12}$

8)

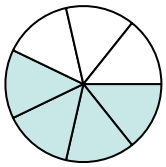

$\frac{4}{7}$

9)

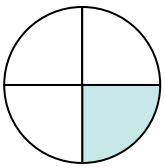

$\frac{1}{4}$

10)

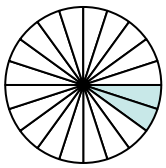

$\frac{2}{20}$

11)



$\frac{10}{20}$

12)

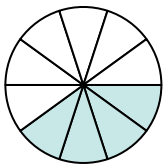

$\frac{4}{10}$

A.

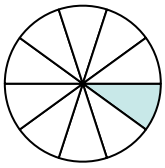

$\frac{1}{10}$

B.

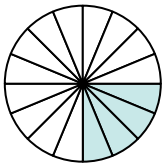

$\frac{4}{16}$

C.

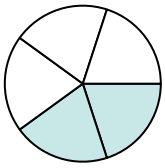

$\frac{2}{5}$

D.

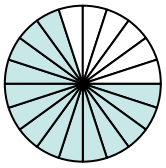

$\frac{14}{20}$

E.

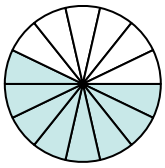

$\frac{8}{14}$

F.

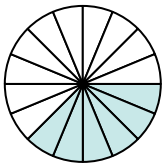

$\frac{6}{16}$

G.

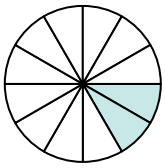

$\frac{2}{12}$

H.

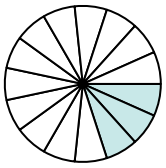

$\frac{3}{15}$

I.

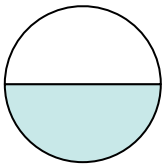

$\frac{1}{2}$

J.

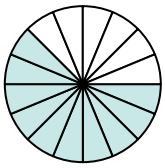

$\frac{10}{16}$

K.

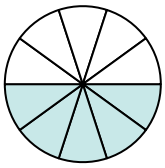

$\frac{5}{10}$

L.

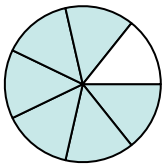

$\frac{6}{7}$

Ответы

1. _____
2. _____
3. _____
4. _____
5. _____
6. _____
7. _____
8. _____
9. _____
10. _____
11. _____
12. _____

1-10	92	83	75	67	58	50	42	33	25	17
11-12	8	0								

Нахождение дроби(визуальное) Имя: Ключ к правильным ответам

Определите под какой буквой находятся соответствующие дроби.

1) 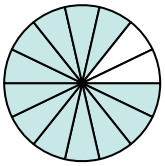

$\frac{12}{14}$

2) 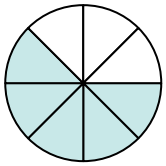

$\frac{5}{8}$

3) 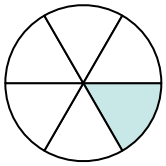

$\frac{1}{6}$

4) 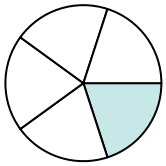

$\frac{1}{5}$

5) 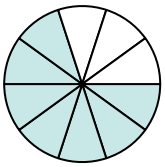

$\frac{7}{10}$

6) 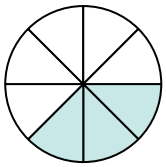

$\frac{3}{8}$

7) 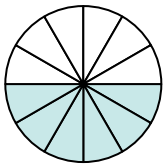

$\frac{6}{12}$

8) 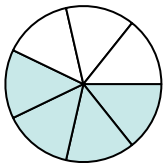

$\frac{4}{7}$

9) 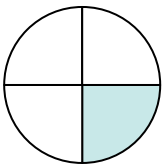

$\frac{1}{4}$

10) 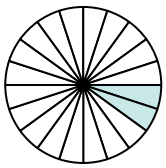

$\frac{2}{20}$

11) 

$\frac{10}{20}$

12) 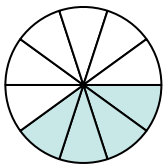

$\frac{4}{10}$

A. 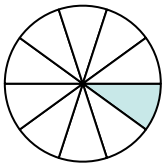

$\frac{1}{10}$

B. 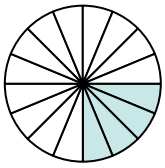

$\frac{4}{16}$

C. 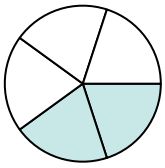

$\frac{2}{5}$

D. 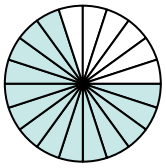

$\frac{14}{20}$

E. 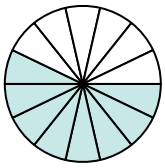

$\frac{8}{14}$

F. 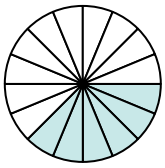

$\frac{6}{16}$

G. 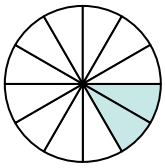

$\frac{2}{12}$

H. 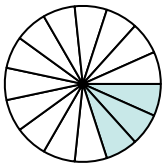

$\frac{3}{15}$

I. 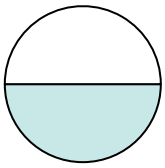

$\frac{1}{2}$

J. 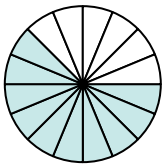

$\frac{10}{16}$

K. 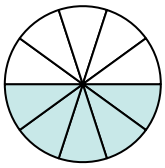

$\frac{5}{10}$

L. 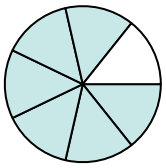

$\frac{6}{7}$

Ответы

1. L
2. J
3. G
4. H
5. D
6. F
7. I
8. E
9. B
10. A
11. K
12. C

1-10	92	83	75	67	58	50	42	33	25	17
11-12	8	0								