Определение разбитых фигур Имя:

Определите под каким вариантом находятся фигуры, разбитые на равные части. Если такой нет, напишите 'нет'.

1) A.  B. 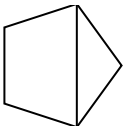 C. 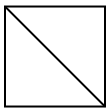 D. 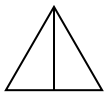

2) A. 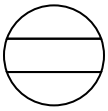 B. 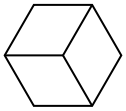 C. 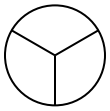 D.

3) A. 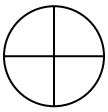 B. 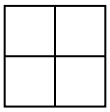 C. 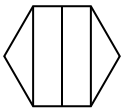 D. 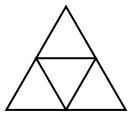

4) A. 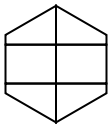 B. 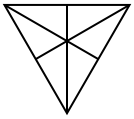 C. 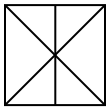 D. 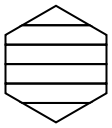

5) A. 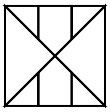 B.  C. 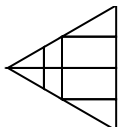 D. 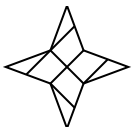

6) A. 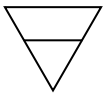 B. 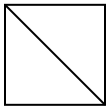 C. 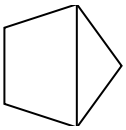 D. 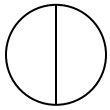

7) A. 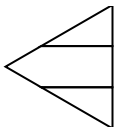 B. 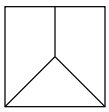 C. 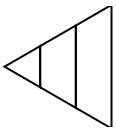 D. 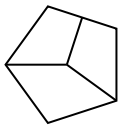

8) A.  B. 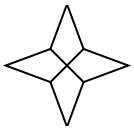 C. 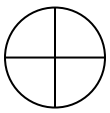 D. 

Ответы

1. _____
2. _____
3. _____
4. _____
5. _____
6. _____
7. _____
8. _____

1-8	88	75	63	50	38	25	13	0

Определение разбитых фигур Имя: Ключ к правильным ответам

Определите под каким вариантом находятся фигуры, разбитые на равные части. Если такой нет, напишите 'нет'.

1) A.  B. 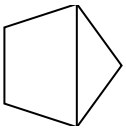 C. 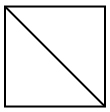 D. 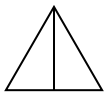

2) A. 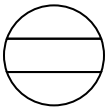 B. 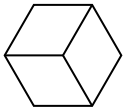 C. 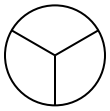 D.

3) A. 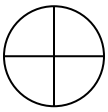 B. 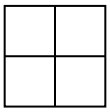 C. 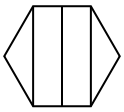 D. 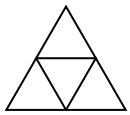

4) A. 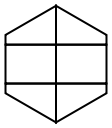 B. 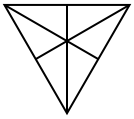 C. 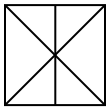 D. 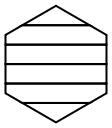

5) A. 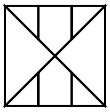 B.  C. 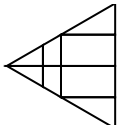 D. 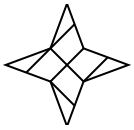

6) A. 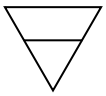 B. 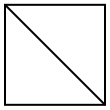 C. 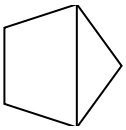 D. 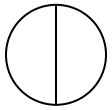

7) A. 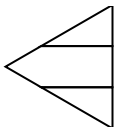 B. 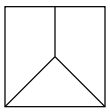 C. 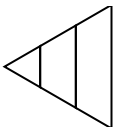 D. 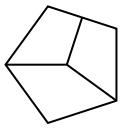

8) A.  B. 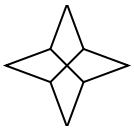 C. 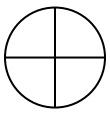 D. 

Ответы

1. C,D
2. B,C
3. A,B,D
4. B
5. B
6. B,D
7. нет
8. A,B,C,D

1-8	88	75	63	50	38	25	13	0

Определите под каким вариантом находятся фигуры, разбитые на равные части. Если такой нет, напишите 'нет'.

1) A. 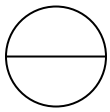 B. C. 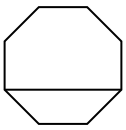 D. 

2) A. 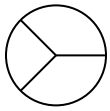 B. 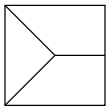 C. 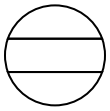 D. 

3) A. 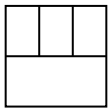 B. 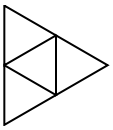 C. 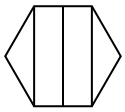 D.

4) A. 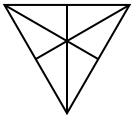 B. 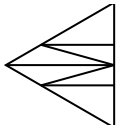 C. 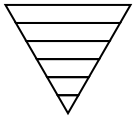 D. 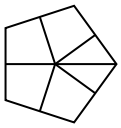

5) A. 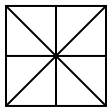 B. 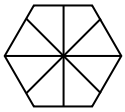 C. 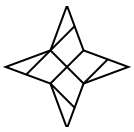 D. 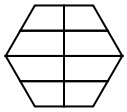

6) A. 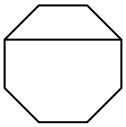 B.  C.  D. 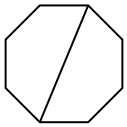

7) A. B. 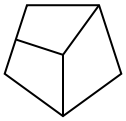 C. 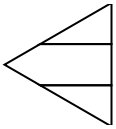 D. 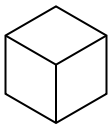

8) A. 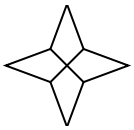 B. 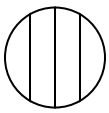 C.  D. 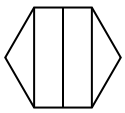

Ответы

1. _____
2. _____
3. _____
4. _____
5. _____
6. _____
7. _____
8. _____

1-8	88	75	63	50	38	25	13	0

Определите под каким вариантом находятся фигуры, разбитые на равные части. Если такой нет, напишите 'нет'.

1) A. 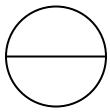 B. C. 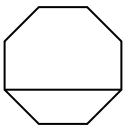 D. 

2) A. 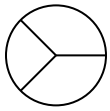 B. 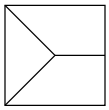 C. 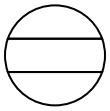 D. 

3) A. 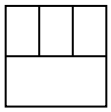 B. 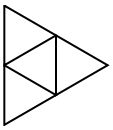 C. 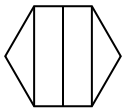 D.

4) A. 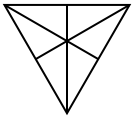 B. 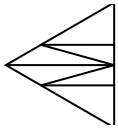 C. 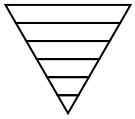 D. 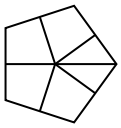

5) A. 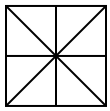 B. 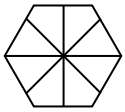 C. 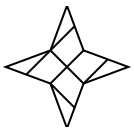 D. 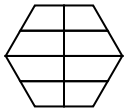

6) A. 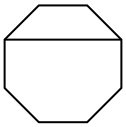 B.  C.  D. 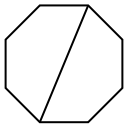

7) A. B. 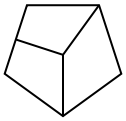 C. 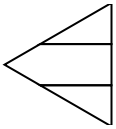 D. 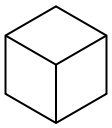

8) A. 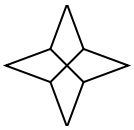 B. 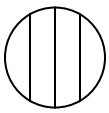 C.  D. 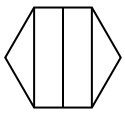

Ответы

1. A,B,D
2. D
3. B,D
4. A
5. A
6. B,C,D
7. A,D
8. A,C

1-8	88	75	63	50	38	25	13	0

Определите под каким вариантом находятся фигуры, разбитые на равные части. Если такой нет, напишите 'нет'.

1) A. B.  C. 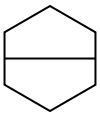 D. 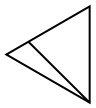

2) A. 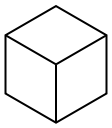 B. 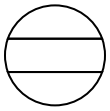 C. 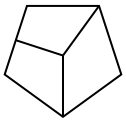 D.

3) A. B. C. 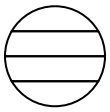 D. 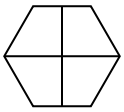

4) A. 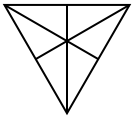 B. 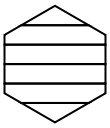 C. 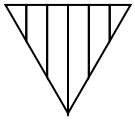 D. 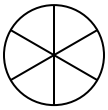

5) A. 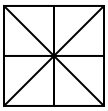 B. 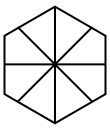 C. 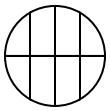 D. 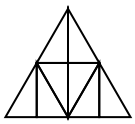

6) A. 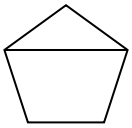 B.  C. 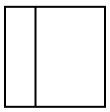 D. 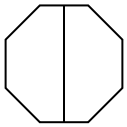

7) A. 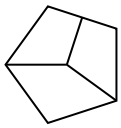 B.  C. D. 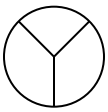

8) A. 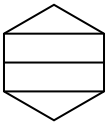 B.  C. 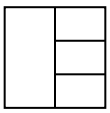 D. 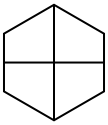

Ответы

1. _____
2. _____
3. _____
4. _____
5. _____
6. _____
7. _____
8. _____

1-8	88	75	63	50	38	25	13	0

Определите под каким вариантом находятся фигуры, разбитые на равные части. Если такой нет, напишите 'нет'.

1) A. B.  C. 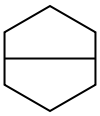 D. 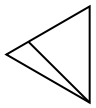

2) A. 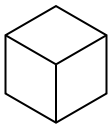 B. 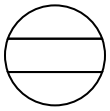 C. 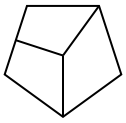 D.

3) A. B. C. 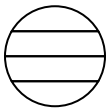 D. 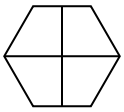

4) A. 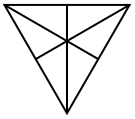 B. 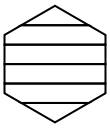 C. 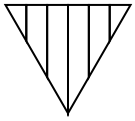 D. 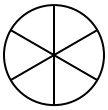

5) A. 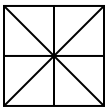 B. 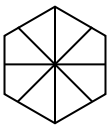 C. 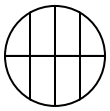 D. 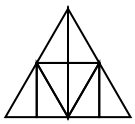

6) A. 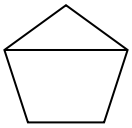 B.  C. 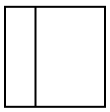 D. 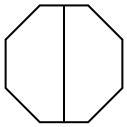

7) A. 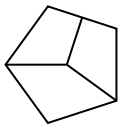 B.  C. D. 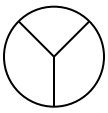

8) A. 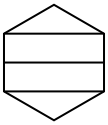 B.  C. 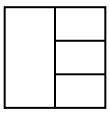 D. 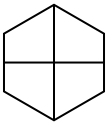

Ответы

1. B,C
2. A,D
3. B,D
4. A,D
5. A,D
6. B,D
7. B
8. D

1-8	88	75	63	50	38	25	13	0

Определите под каким вариантом находятся фигуры, разбитые на равные части. Если такой нет, напишите 'нет'.

1) A.  B.  C. D. 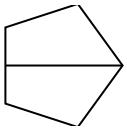

2) A. 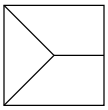 B. 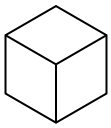 C. 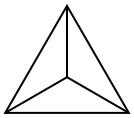 D.

3) A. 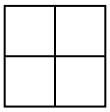 B. C. 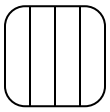 D. 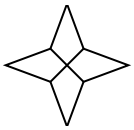

4) A. 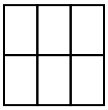 B. 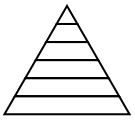 C. 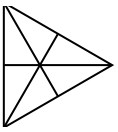 D. 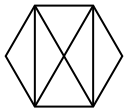

5) A. 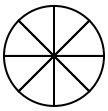 B. 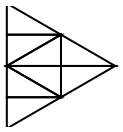 C. 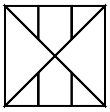 D. 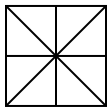

6) A.  B. 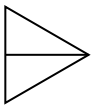 C. 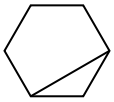 D.

7) A. B. 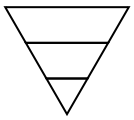 C. 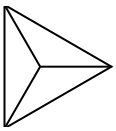 D. 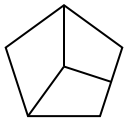

8) A. 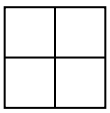 B.  C. D. 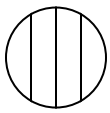

Ответы

1. _____
2. _____
3. _____
4. _____
5. _____
6. _____
7. _____
8. _____

1-8	88	75	63	50	38	25	13	0

Определите под каким вариантом находятся фигуры, разбитые на равные части. Если такой нет, напишите 'нет'.

1) A.  B.  C. D. 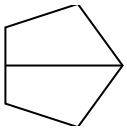

2) A. 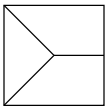 B. 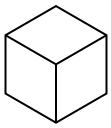 C. 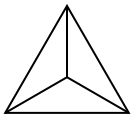 D.

3) A. 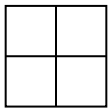 B. C. 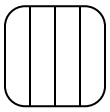 D. 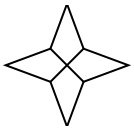

4) A.  B. 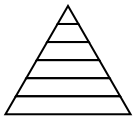 C. 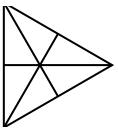 D. 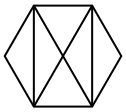

5) A. 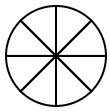 B. 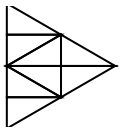 C. 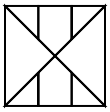 D. 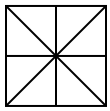

6) A.  B. 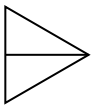 C. 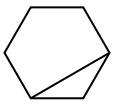 D.

7) A. B. 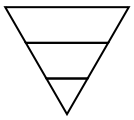 C. 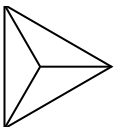 D. 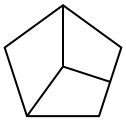

8) A.  B.  C. D. 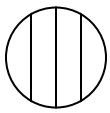

Ответы

1. A,B,C,D
2. B,C
3. A,B,D
4. A,C
5. A,B,D
6. A,B
7. C
8. A,B

1-8	88	75	63	50	38	25	13	0

Определите под каким вариантом находятся фигуры, разбитые на равные части. Если такой нет, напишите 'нет'.

1) A. B. 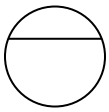 C. 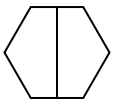 D. 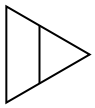

2) A. B. 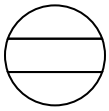 C. 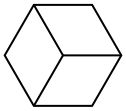 D. 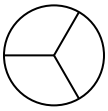

3) A. 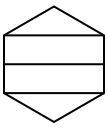 B.  C. D. 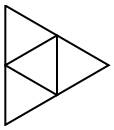

4) A. 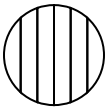 B. 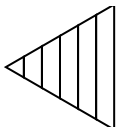 C. 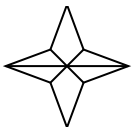 D. 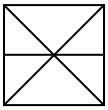

5) A. 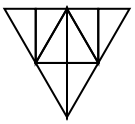 B. 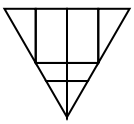 C. D. 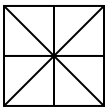

6) A. 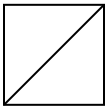 B. 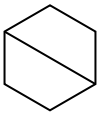 C. 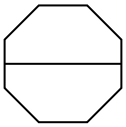 D. 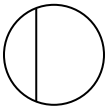

7) A. 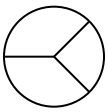 B. 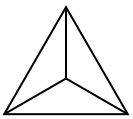 C. 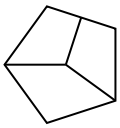 D.

8) A. B. C. 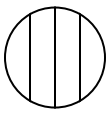 D. 

Ответы

1. _____
2. _____
3. _____
4. _____
5. _____
6. _____
7. _____
8. _____

1-8	88	75	63	50	38	25	13	0

Определите под каким вариантом находятся фигуры, разбитые на равные части. Если такой нет, напишите 'нет'.

1) A. B. 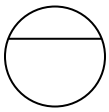 C. 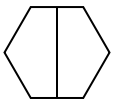 D. 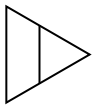

2) A. B. 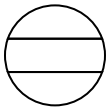 C. 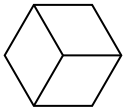 D. 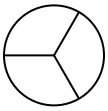

3) A. 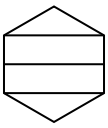 B.  C. D. 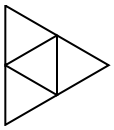

4) A. 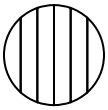 B. 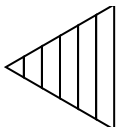 C. 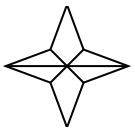 D. 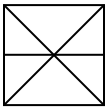

5) A. 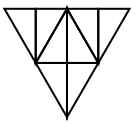 B. 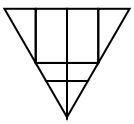 C. D. 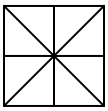

6) A. 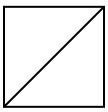 B. 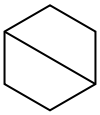 C. 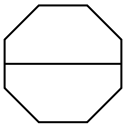 D. 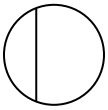

7) A. 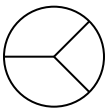 B. 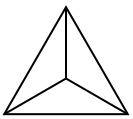 C. 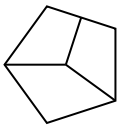 D.

8) A. B. C. 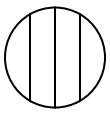 D. 

Ответы

1. A,C
2. C,D
3. D
4. нет
5. A,D
6. A,B,C
7. B
8. A,D

1-8	88	75	63	50	38	25	13	0

Определите под каким вариантом находятся фигуры, разбитые на равные части. Если такой нет, напишите 'нет'.

1) A. 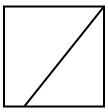 B. 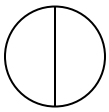 C. 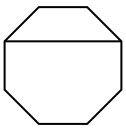 D. 

2) A. 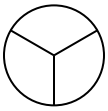 B. 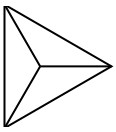 C. 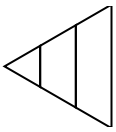 D.

3) A. 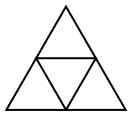 B. 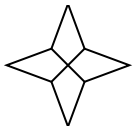 C. 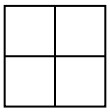 D.

4) A. 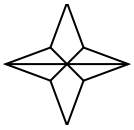 B. 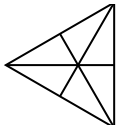 C. 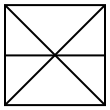 D. 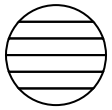

5) A. 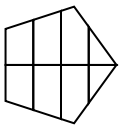 B. 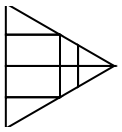 C.  D. 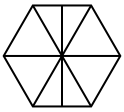

6) A. 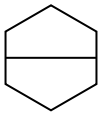 B. C. D. 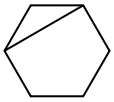

7) A.  B. 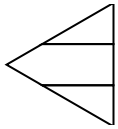 C. 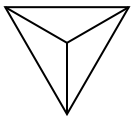 D. 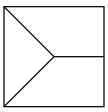

8) A.  B. 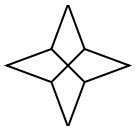 C. 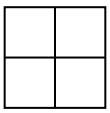 D. 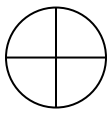

Ответы

1. _____
2. _____
3. _____
4. _____
5. _____
6. _____
7. _____
8. _____

1-8	88	75	63	50	38	25	13	0

Определите под каким вариантом находятся фигуры, разбитые на равные части. Если такой нет, напишите 'нет'.

1) A. 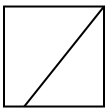 B. 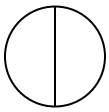 C. 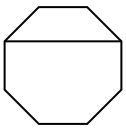 D. 

2) A. 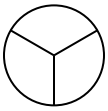 B. 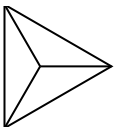 C. 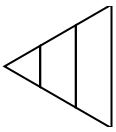 D.

3) A. 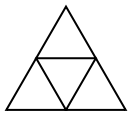 B. 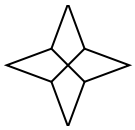 C. 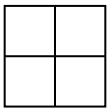 D.

4) A. 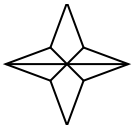 B. 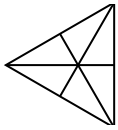 C. 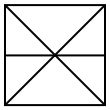 D. 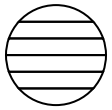

5) A. 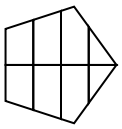 B. 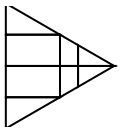 C.  D. 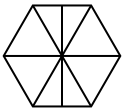

6) A. 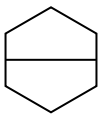 B. C. D. 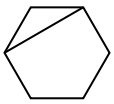

7) A.  B. 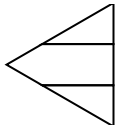 C. 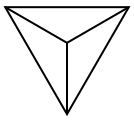 D. 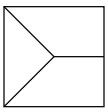

8) A.  B. 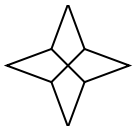 C. 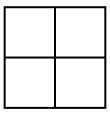 D. 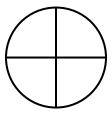

Ответы

1. B
2. A,B
3. A,B,C,D
4. B
5. C
6. A,C
7. A,C
8. B,C,D

1-8	88	75	63	50	38	25	13	0

Определение разбитых фигур Имя:

Определите под каким вариантом находятся фигуры, разбитые на равные части. Если такой нет, напишите 'нет'.

1) A.  B. 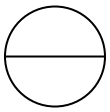 C.  D. 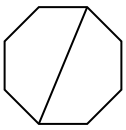

2) A. 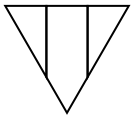 B. 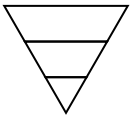 C. 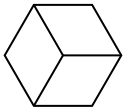 D. 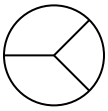

3) A. 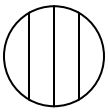 B.  C. 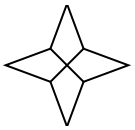 D. 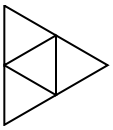

4) A. B. 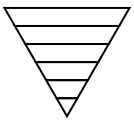 C. 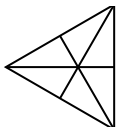 D. 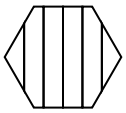

5) A. 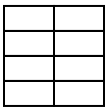 B. 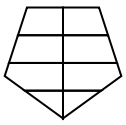 C. 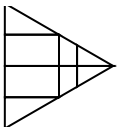 D. 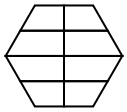

6) A. B. 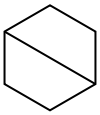 C. 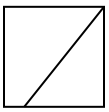 D. 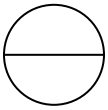

7) A. 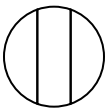 B. 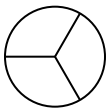 C.  D.

8) A. 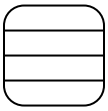 B. 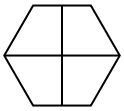 C.  D. 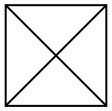

Ответы

1. _____
2. _____
3. _____
4. _____
5. _____
6. _____
7. _____
8. _____

1-8	88	75	63	50	38	25	13	0

Определите под каким вариантом находятся фигуры, разбитые на равные части. Если такой нет, напишите 'нет'.

1) A.  B. 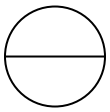 C.  D. 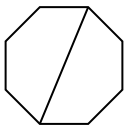

2) A. 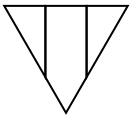 B. 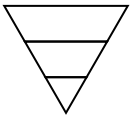 C. 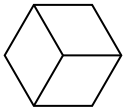 D. 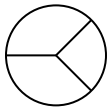

3) A. 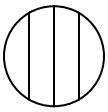 B.  C. 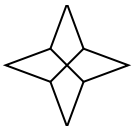 D. 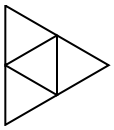

4) A. B. 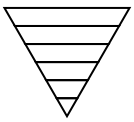 C. 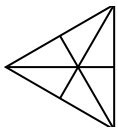 D. 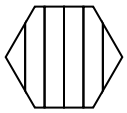

5) A. 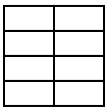 B. 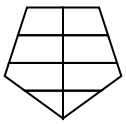 C. 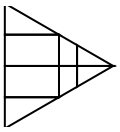 D. 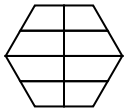

6) A. B. 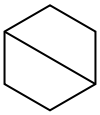 C. 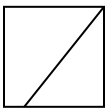 D. 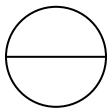

7) A. 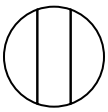 B. 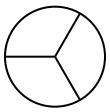 C.  D.

8) A. 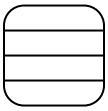 B. 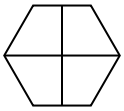 C.  D. 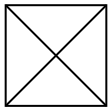

Ответы

1. A,B,D
2. C
3. B,C,D
4. C
5. A
6. A,B,D
7. B,C
8. B,C,D

1-8	88	75	63	50	38	25	13	0

Определите под каким вариантом находятся фигуры, разбитые на равные части. Если такой нет, напишите 'нет'.

1) A. 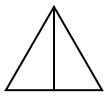 B. 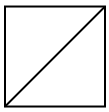 C. 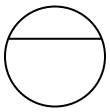 D. 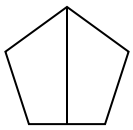

2) A. 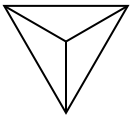 B.  C. 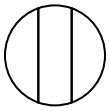 D. 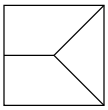

3) A. B. 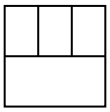 C.  D. 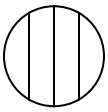

4) A. 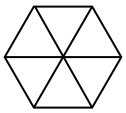 B. 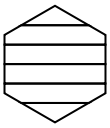 C. 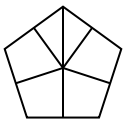 D. 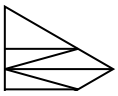

5) A. 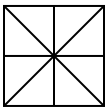 B. 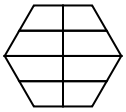 C.  D. 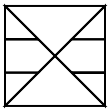

6) A. 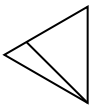 B. 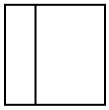 C. 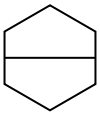 D. 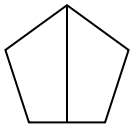

7) A. 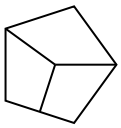 B. 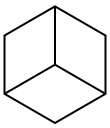 C. 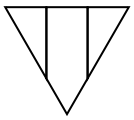 D.

8) A.  B. 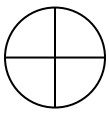 C.  D.

Ответы

1. _____
2. _____
3. _____
4. _____
5. _____
6. _____
7. _____
8. _____

1-8	88	75	63	50	38	25	13	0

Определите под каким вариантом находятся фигуры, разбитые на равные части. Если такой нет, напишите 'нет'.

1) A. 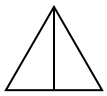 B. 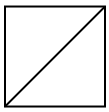 C. 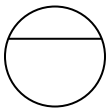 D. 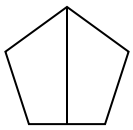

2) A. 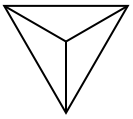 B.  C. 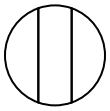 D. 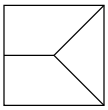

3) A. B. 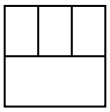 C.  D. 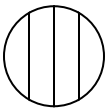

4) A. 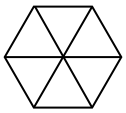 B. 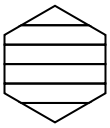 C. 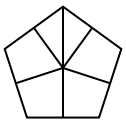 D. 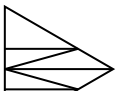

5) A. 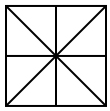 B. 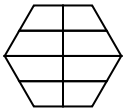 C.  D. 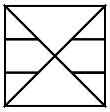

6) A. 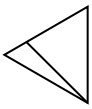 B. 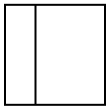 C. 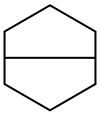 D. 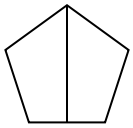

7) A. 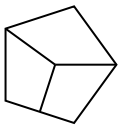 B. 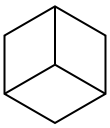 C. 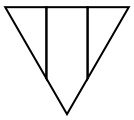 D.

8) A.  B. 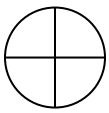 C.  D.

Ответы

1. A,B,D
2. A,B
3. A,C
4. A
5. A,C
6. C,D
7. B
8. A,B

1-8	88	75	63	50	38	25	13	0

Определите под каким вариантом находятся фигуры, разбитые на равные части. Если такой нет, напишите 'нет'.

1) A.  B. 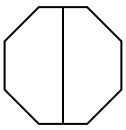 C. 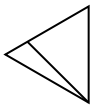 D. 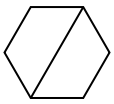

2) A. 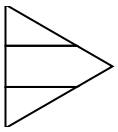 B.  C. D. 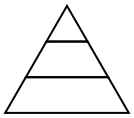

3) A. 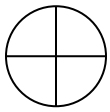 B. C.  D. 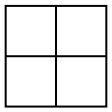

4) A. 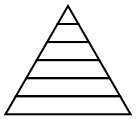 B. 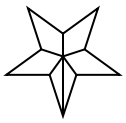 C. 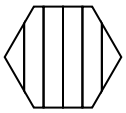 D. 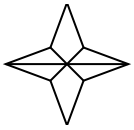

5) A. 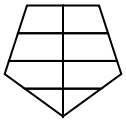 B. 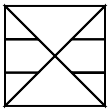 C. 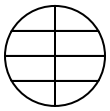 D. 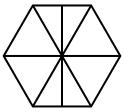

6) A. 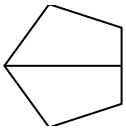 B. 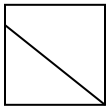 C. 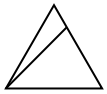 D. 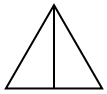

7) A. B. 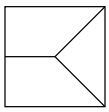 C. 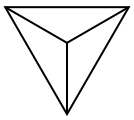 D. 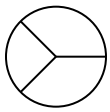

8) A. 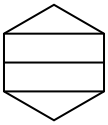 B.  C. 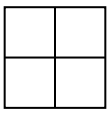 D. 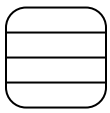

Ответы

1. _____
2. _____
3. _____
4. _____
5. _____
6. _____
7. _____
8. _____

1-8	88	75	63	50	38	25	13	0

Определите под каким вариантом находятся фигуры, разбитые на равные части. Если такой нет, напишите 'нет'.

1) A.  B. 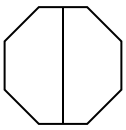 C. 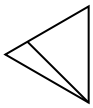 D. 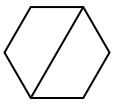

2) A. 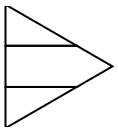 B.  C. D. 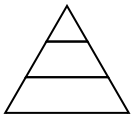

3) A. 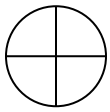 B. C.  D. 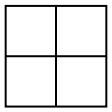

4) A. 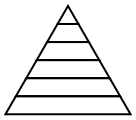 B. 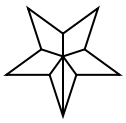 C. 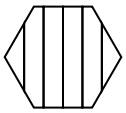 D. 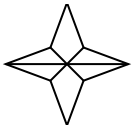

5) A. 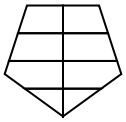 B. 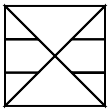 C. 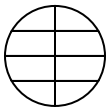 D. 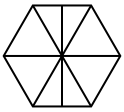

6) A. 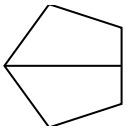 B. 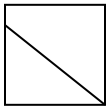 C. D. 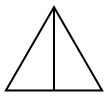

7) A. B. 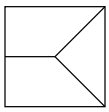 C. 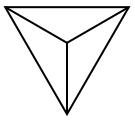 D. 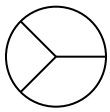

8) A. 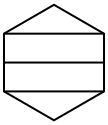 B.  C. 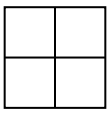 D. 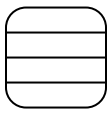

Ответы

1. A,B,D
2. B
3. A,B,D
4. нет
5. нет
6. A,D
7. C
8. B,C

1-8	88	75	63	50	38	25	13	0

Определите под каким вариантом находятся фигуры, разбитые на равные части. Если такой нет, напишите 'нет'.

1) A.  B. 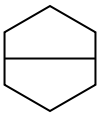 C.  D.

2) A. 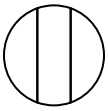 B. 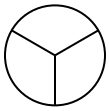 C. 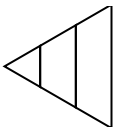 D.

3) A. 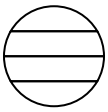 B.  C. 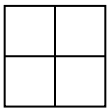 D. 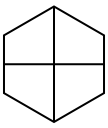

4) A. 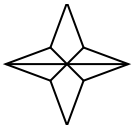 B. 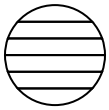 C. 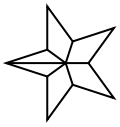 D. 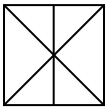

5) A. 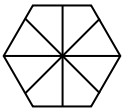 B. 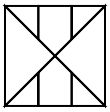 C. 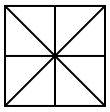 D.

6) A. 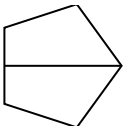 B. 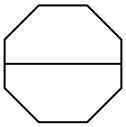 C.  D. 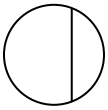

7) A.  B. 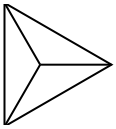 C. D. 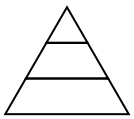

8) A. 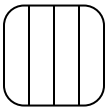 B. 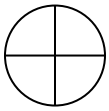 C. 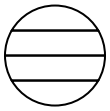 D.

Ответы

1. _____
2. _____
3. _____
4. _____
5. _____
6. _____
7. _____
8. _____

1-8	88	75	63	50	38	25	13	0

Определите под каким вариантом находятся фигуры, разбитые на равные части. Если такой нет, напишите 'нет'.

1) A.  B. 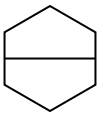 C.  D.

2) A. 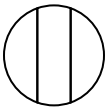 B. 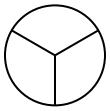 C. 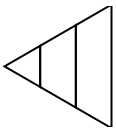 D.

3) A. 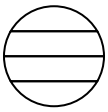 B.  C. 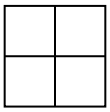 D. 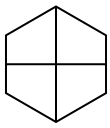

4) A. 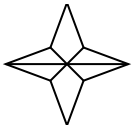 B. 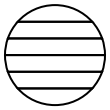 C. 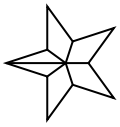 D. 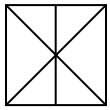

5) A. 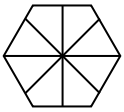 B. 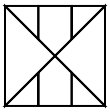 C. 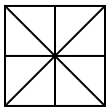 D.

6) A. 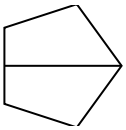 B. 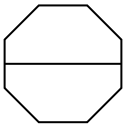 C.  D. 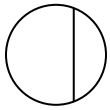

7) A.  B. 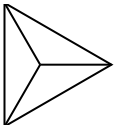 C. D. 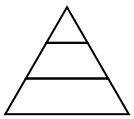

8) A. 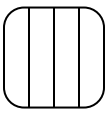 B. 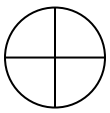 C. 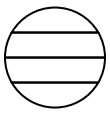 D.

Ответы

1. A,B,C
2. B
3. B,C,D
4. нет
5. C
6. A,B,C
7. A,B
8. B,D

1-8	88	75	63	50	38	25	13	0