Деление дробей и чисел по числовой прямой Имя:

Используйте числовую прямую для решения задачи. Первая отмечена для Вас.

1) $\frac{1}{5}:5$



2) $\frac{1}{7}:3$



3) $\frac{1}{7}:2$



4) $\frac{1}{7}:5$



5) $\frac{1}{4}:6$

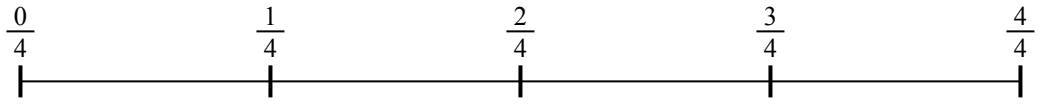

6) $\frac{1}{6}:3$

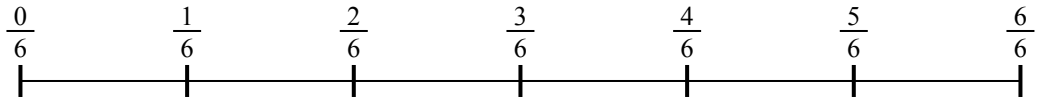

7) $\frac{1}{6}:4$

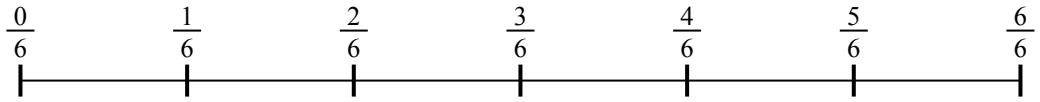

8) $\frac{1}{3}:6$



9) $\frac{1}{5}:2$



Ответы

1. _____
2. _____
3. _____
4. _____
5. _____
6. _____
7. _____
8. _____
9. _____

1-9	89	78	67	56	44	33	22	11	0

Используйте числовую прямую для решения задачи. Первая отмечена для Вас.

1) $\frac{1}{5}:5$

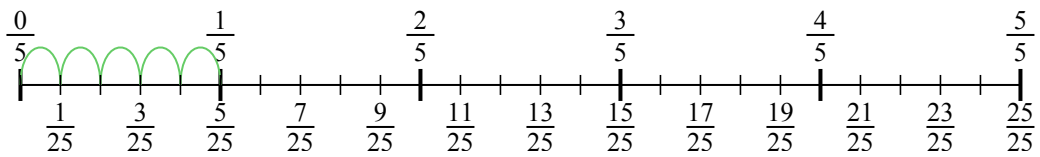

2) $\frac{1}{7}:3$

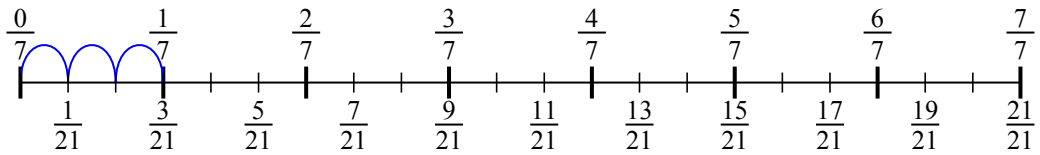

3) $\frac{1}{7}:2$

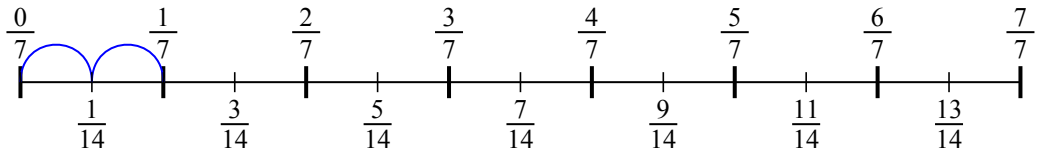

4) $\frac{1}{7}:5$

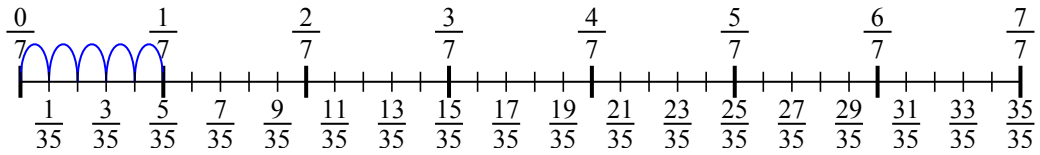

5) $\frac{1}{4}:6$

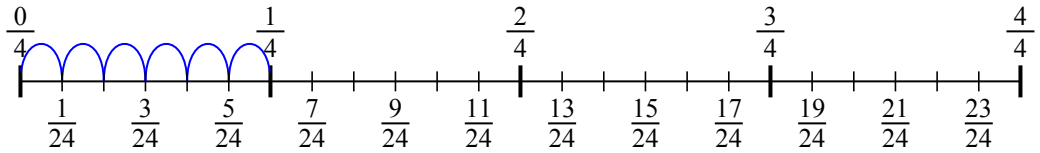

6) $\frac{1}{6}:3$

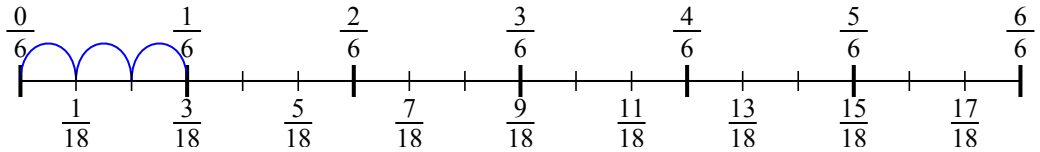

7) $\frac{1}{6}:4$

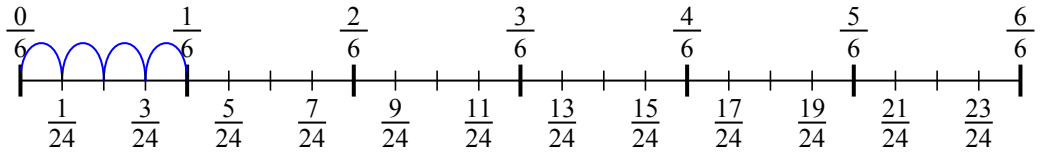

8) $\frac{1}{3}:6$

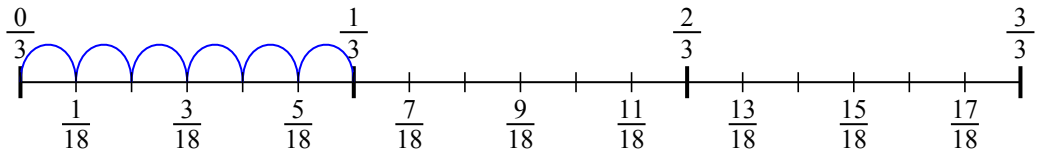

9) $\frac{1}{5}:2$

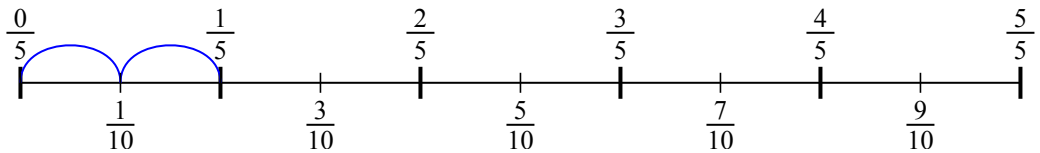

Ответы

1. $\frac{1}{25}$
2. $\frac{1}{21}$
3. $\frac{1}{14}$
4. $\frac{1}{35}$
5. $\frac{1}{24}$
6. $\frac{1}{18}$
7. $\frac{1}{24}$
8. $\frac{1}{18}$
9. $\frac{1}{10}$

1-9	89	78	67	56	44	33	22	11	0

Деление дробей и чисел по числовой прямой Имя:

Используйте числовую прямую для решения задачи. Первая отмечена для Вас.

$\frac{1}{18}$	$\frac{1}{35}$	$\frac{1}{18}$	$\frac{1}{21}$
$\frac{1}{24}$	$\frac{1}{14}$	$\frac{1}{10}$	$\frac{1}{25}$
$\frac{1}{24}$			

1) $\frac{1}{5}:5$



2) $\frac{1}{7}:3$



3) $\frac{1}{7}:2$



4) $\frac{1}{7}:5$



5) $\frac{1}{4}:6$

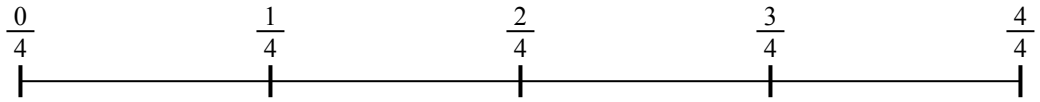

6) $\frac{1}{6}:3$

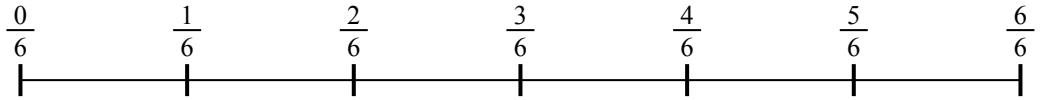

7) $\frac{1}{6}:4$

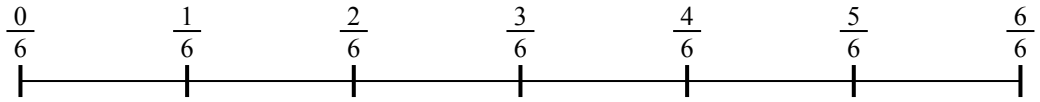

8) $\frac{1}{3}:6$



9) $\frac{1}{5}:2$



Ответы

1. _____
2. _____
3. _____
4. _____
5. _____
6. _____
7. _____
8. _____
9. _____

1-9	89	78	67	56	44	33	22	11	0