Определите какая дробь должна находиться посередине.

1) $^3/_8$ < ? < $^3/_4$

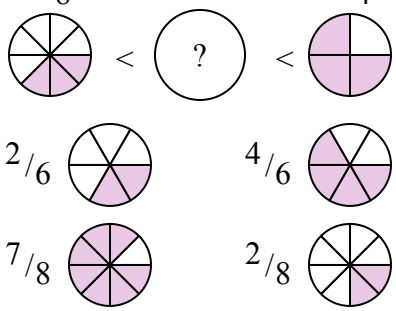

2) $^2/_8$ < ? < $^4/_8$

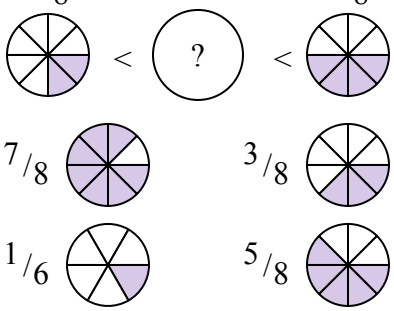

3) $^1/_6$ < ? < $^3/_6$

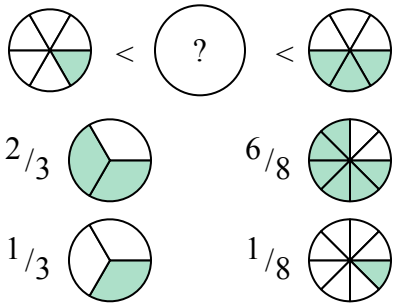

4) $^2/_8$ < ? < $^3/_8$

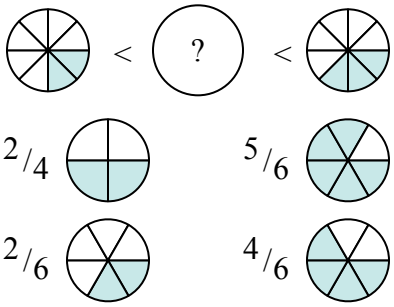

5) $^3/_8$ < ? < $^6/_8$

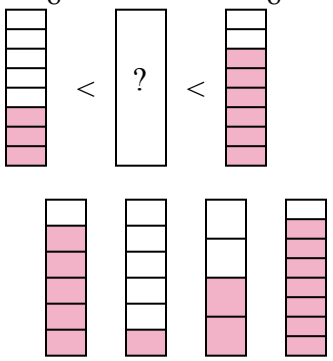

$^5/_6$ $^1/_6$ $^2/_4$ $^7/_8$

6) $^2/_8$ < ? < $^3/_8$

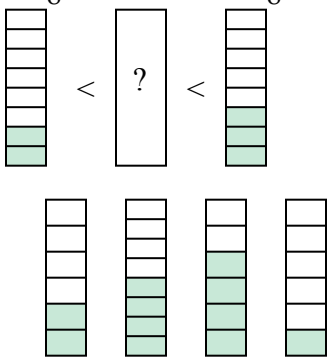

$^2/_6$ $^4/_8$ $^4/_6$ $^1/_6$

7) $^1/_3$ < ? < $^5/_8$

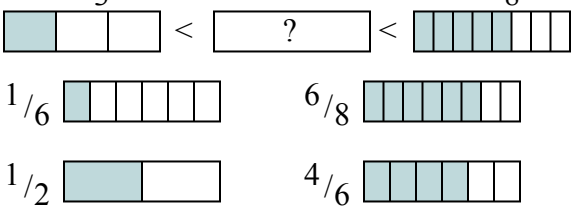

8) $^3/_8$ < ? < $^2/_3$

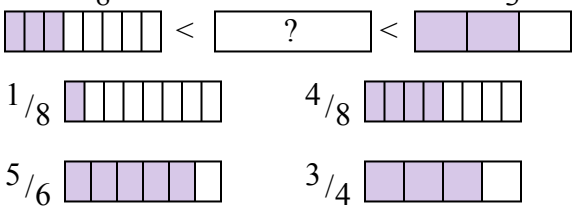

Ответы

1. _____
2. _____
3. _____
4. _____
5. _____
6. _____
7. _____
8. _____

1-8	88	75	63	50	38	25	13	0

Определите какая дробь должна находиться посередине.

1) $^3/_8$ < ? < $^3/_4$

$^2/_6$ $^4/_6$ $^7/_8$ $^2/_8$

2) $^2/_8$ < ? < $^4/_8$

$^7/_8$ $^3/_8$ $^1/_6$ $^5/_8$

3) $^1/_6$ < ? < $^3/_6$

$^2/_3$ $^6/_8$ $^1/_3$ $^1/_8$

4) $^2/_8$ < ? < $^3/_8$

$^2/_4$ $^5/_6$ $^2/_6$ $^4/_6$

5) $^3/_8$ < ? < $^6/_8$

$^5/_6$ $^1/_6$ $^2/_4$ $^7/_8$

6) $^2/_8$ < ? < $^3/_8$

$^2/_6$ $^4/_8$ $^4/_6$ $^1/_6$

7) $^1/_3$ < ? < $^5/_8$

$^1/_6$ $^6/_8$ $^1/_2$ $^4/_6$

8) $^3/_8$ < ? < $^2/_3$

$^1/_8$ $^4/_8$ $^5/_6$ $^3/_4$

Ответы

1. $^4/_6$
2. $^3/_8$
3. $^1/_3$
4. $^2/_6$
5. $^2/_4$
6. $^2/_6$
7. $^1/_2$
8. $^4/_8$

1-8	88	75	63	50	38	25	13	0