Определите какая дробь должна находиться посередине.

1) $^{2}/_{4}$ < ? < $^{6}/_{8}$

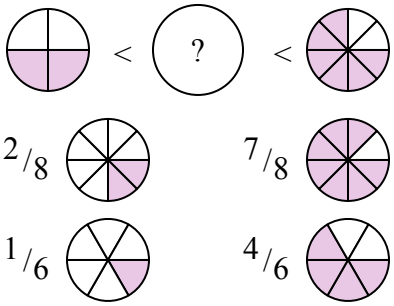

2) $^{2}/_{6}$ < ? < $^{2}/_{3}$

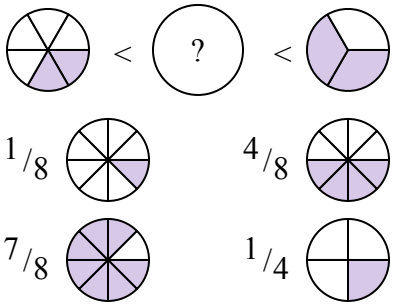

3) $^{5}/_{8}$ < ? < $^{6}/_{8}$

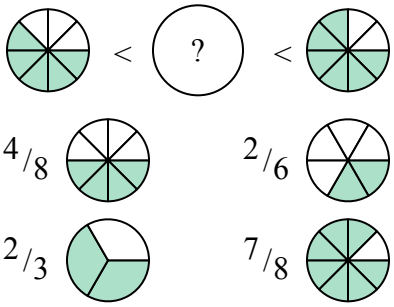

4) $^{1}/_{4}$ < ? < $^{3}/_{8}$

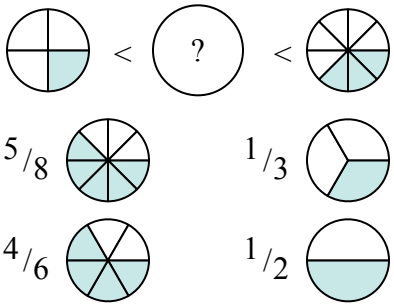

5) $^{1}/_{8}$ < ? < $^{1}/_{2}$

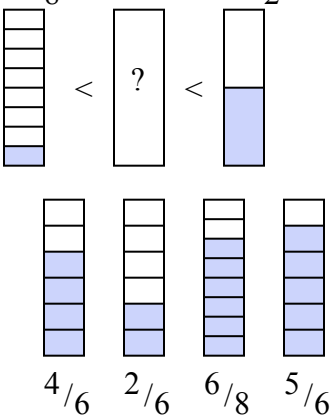

6) $^{3}/_{6}$ < ? < $^{2}/_{3}$

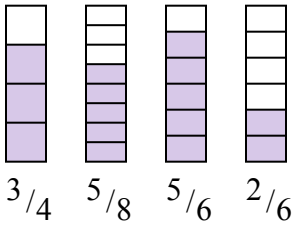

7) $^{1}/_{8}$ < ? < $^{3}/_{6}$

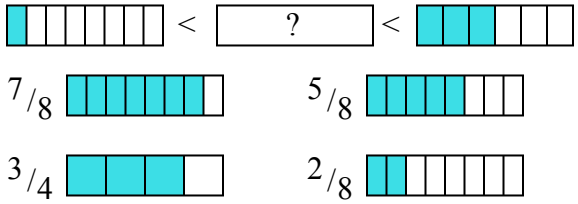

8) $^{4}/_{8}$ < ? < $^{5}/_{6}$

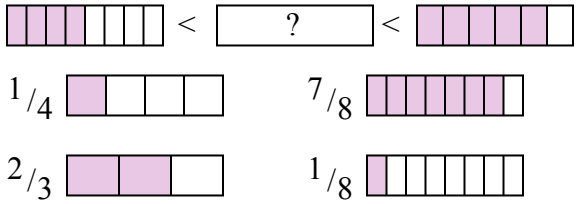

Ответы

1. _____
2. _____
3. _____
4. _____
5. _____
6. _____
7. _____
8. _____

1-8	88	75	63	50	38	25	13	0

Определите какая дробь должна находиться посередине.

1) $^{2}/_{4}$ < ? < $^{6}/_{8}$

$^{2}/_{8}$ $^{7}/_{8}$ $^{1}/_{6}$ $^{4}/_{6}$

2) $^{2}/_{6}$ < ? < $^{2}/_{3}$

$^{1}/_{8}$ $^{4}/_{8}$ $^{7}/_{8}$ $^{1}/_{4}$

3) $^{5}/_{8}$ < ? < $^{6}/_{8}$

$^{4}/_{8}$ $^{2}/_{6}$ $^{2}/_{3}$ $^{7}/_{8}$

4) $^{1}/_{4}$ < ? < $^{3}/_{8}$

$^{5}/_{8}$ $^{1}/_{3}$ $^{4}/_{6}$ $^{1}/_{2}$

5) $^{1}/_{8}$ < ? < $^{1}/_{2}$

$^{4}/_{6}$ $^{2}/_{6}$ $^{6}/_{8}$ $^{5}/_{6}$

6) $^{3}/_{6}$ < ? < $^{2}/_{3}$

$^{3}/_{4}$ $^{5}/_{8}$ $^{5}/_{6}$ $^{2}/_{6}$

7) $^{1}/_{8}$ < ? < $^{3}/_{6}$

$^{7}/_{8}$ $^{5}/_{8}$ $^{3}/_{4}$ $^{2}/_{8}$

8) $^{4}/_{8}$ < ? < $^{5}/_{6}$

$^{1}/_{4}$ $^{7}/_{8}$ $^{2}/_{3}$ $^{1}/_{8}$

Ответы

1. $^{4}/_{6}$
2. $^{4}/_{8}$
3. $^{2}/_{3}$
4. $^{1}/_{3}$
5. $^{2}/_{6}$
6. $^{5}/_{8}$
7. $^{2}/_{8}$
8. $^{2}/_{3}$

1-8	88	75	63	50	38	25	13	0