Написание дробей

Имя:

Напишите дробь, равную закрашенной части в фигуре.

1) 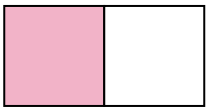

2) 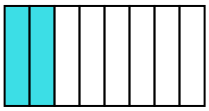

3) 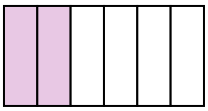

4) 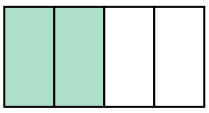

5) 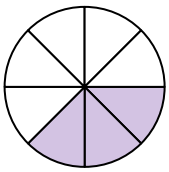

6) 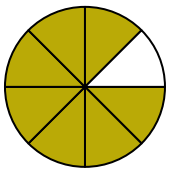

7) 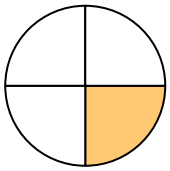

8) 

9) 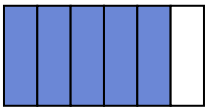

10) 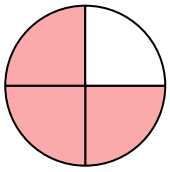

11) 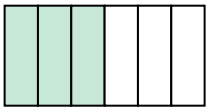

12) 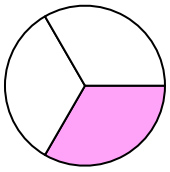

13) 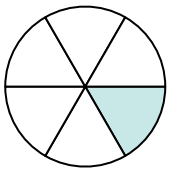

14) 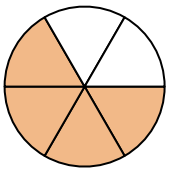

15) 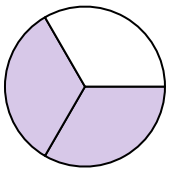

16) 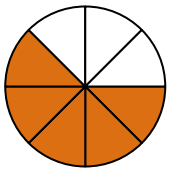

17) 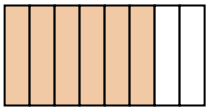

18) 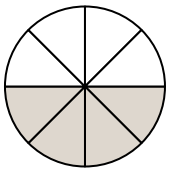

Ответы

1. _____
2. _____
3. _____
4. _____
5. _____
6. _____
7. _____
8. _____
9. _____
10. _____
11. _____
12. _____
13. _____
14. _____
15. _____
16. _____
17. _____
18. _____

1-10	94	89	83	78	72	67	61	56	50	44
11-18	39	33	28	22	17	11	6	0		

Написание дробей

Имя: **Ключ к правильным ответам**

Напишите дробь, равную закрашенной части в фигуре.

1) 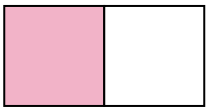

2) 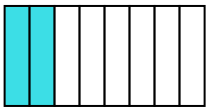

3) 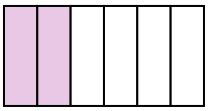

4) 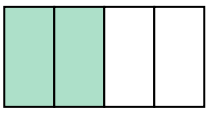

5) 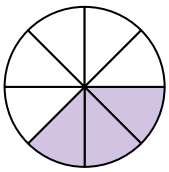

6) 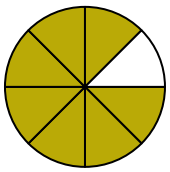

7) 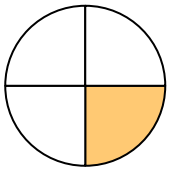

8) 

9) 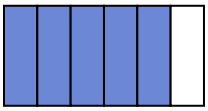

10) 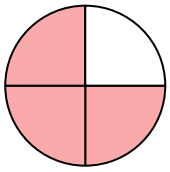

11) 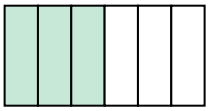

12) 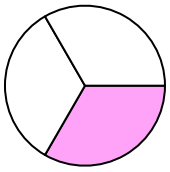

13) 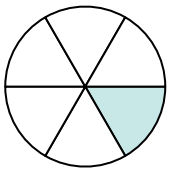

14) 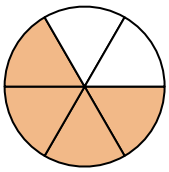

15) 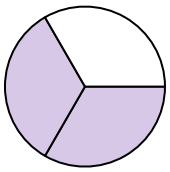

16) 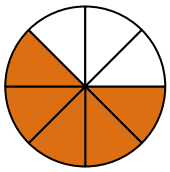

17) 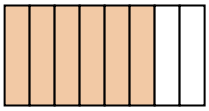

18) 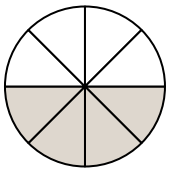

Ответы

1. $\frac{1}{2}$
2. $\frac{2}{8}$
3. $\frac{2}{6}$
4. $\frac{2}{4}$
5. $\frac{3}{8}$
6. $\frac{7}{8}$
7. $\frac{1}{4}$
8. $\frac{1}{8}$
9. $\frac{5}{6}$
10. $\frac{3}{4}$
11. $\frac{3}{6}$
12. $\frac{1}{3}$
13. $\frac{1}{6}$
14. $\frac{4}{6}$
15. $\frac{2}{3}$
16. $\frac{5}{8}$
17. $\frac{6}{8}$
18. $\frac{4}{8}$

1-10	94	89	83	78	72	67	61	56	50	44
11-18	39	33	28	22	17	11	6	0		

Написание дробей Имя:

Напишите дробь, равную закрашенной части в фигуре.

1) 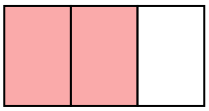

2) 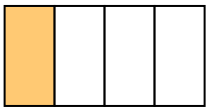

3) 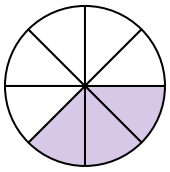

4) 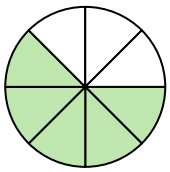

5) 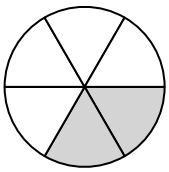

6) 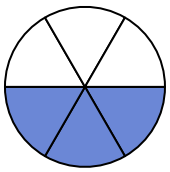

7) 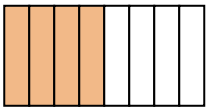

8) 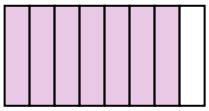

9) 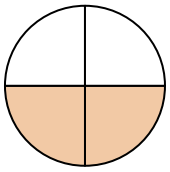

10) 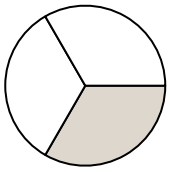

11)

12)

13) 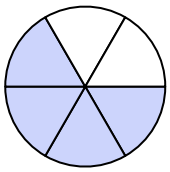

14) 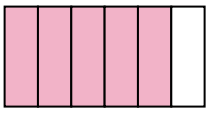

15) 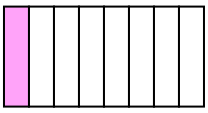

16) 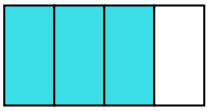

17) 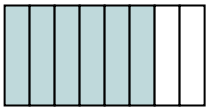

18) 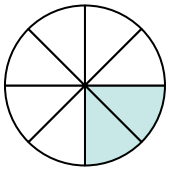

Ответы

1. _____
2. _____
3. _____
4. _____
5. _____
6. _____
7. _____
8. _____
9. _____
10. _____
11. _____
12. _____
13. _____
14. _____
15. _____
16. _____
17. _____
18. _____

1-10	94	89	83	78	72	67	61	56	50	44
11-18	39	33	28	22	17	11	6	0		

Написание дробей

Имя: **Ключ к правильным ответам**

Напишите дробь, равную закрашенной части в фигуре.

1) 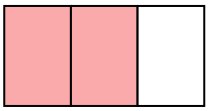

2) 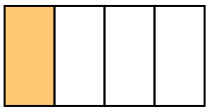

3) 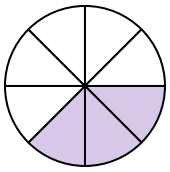

4) 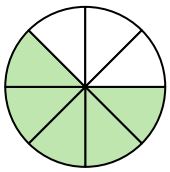

5) 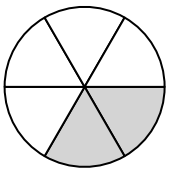

6) 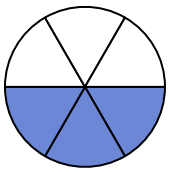

7) 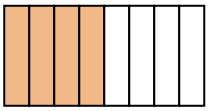

8) 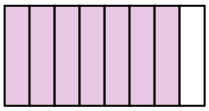

9) 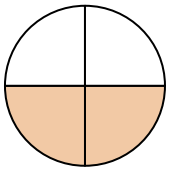

10) 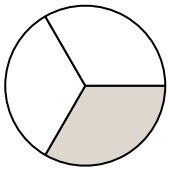

11)

12)

13) 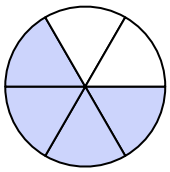

14) 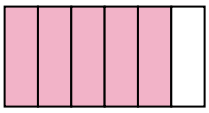

15) 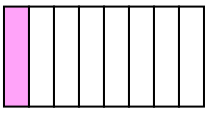

16) 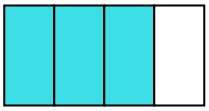

17) 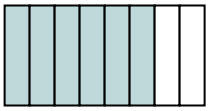

18) 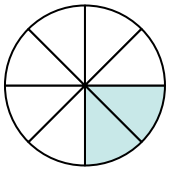

Ответы

1. $^{2}/_{3}$
2. $^{1}/_{4}$
3. $^{3}/_{8}$
4. $^{5}/_{8}$
5. $^{2}/_{6}$
6. $^{3}/_{6}$
7. $^{4}/_{8}$
8. $^{7}/_{8}$
9. $^{2}/_{4}$
10. $^{1}/_{3}$
11. $^{1}/_{2}$
12. $^{1}/_{6}$
13. $^{4}/_{6}$
14. $^{5}/_{6}$
15. $^{1}/_{8}$
16. $^{3}/_{4}$
17. $^{6}/_{8}$
18. $^{2}/_{8}$

1-10	94	89	83	78	72	67	61	56	50	44
11-18	39	33	28	22	17	11	6	0		

Написание дробей

Имя:

Напишите дробь, равную закрашенной части в фигуре.

1)

2) 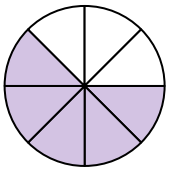

3) 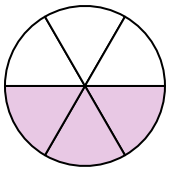

4) 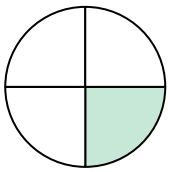

5) 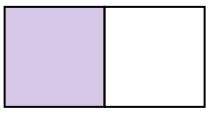

6) 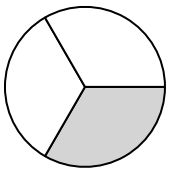

7) 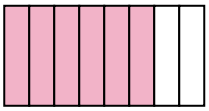

8) 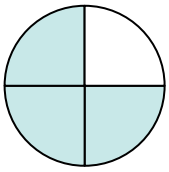

9) 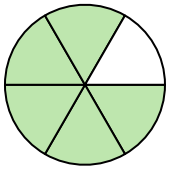

10) 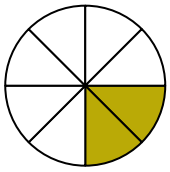

11) 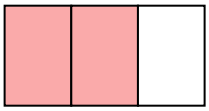

12) 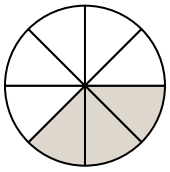

13) 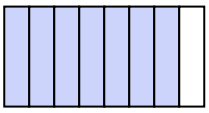

14) 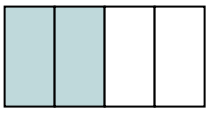

15) 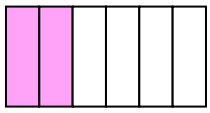

16) 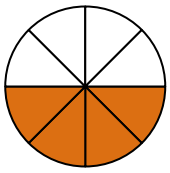

17) 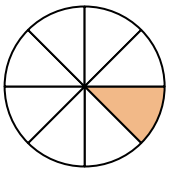

18) 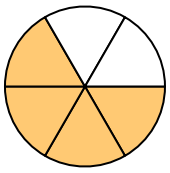

Ответы

1. _____
2. _____
3. _____
4. _____
5. _____
6. _____
7. _____
8. _____
9. _____
10. _____
11. _____
12. _____
13. _____
14. _____
15. _____
16. _____
17. _____
18. _____

1-10	94	89	83	78	72	67	61	56	50	44
11-18	39	33	28	22	17	11	6	0		

Написание дробей

Имя: **Ключ к правильным ответам**

Напишите дробь, равную закрашенной части в фигуре.

1)

2) 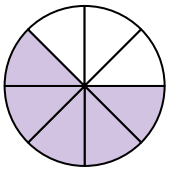

3) 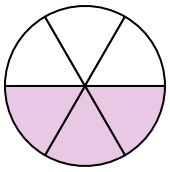

4) 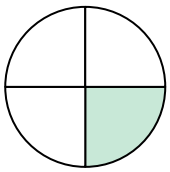

5) 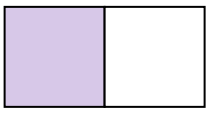

6) 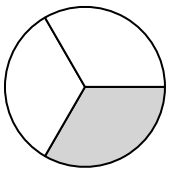

7) 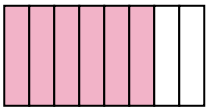

8) 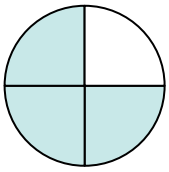

9) 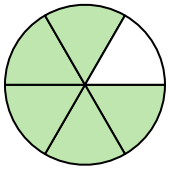

10) 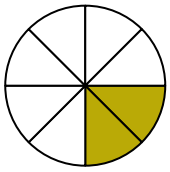

11) 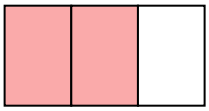

12) 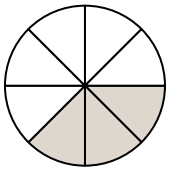

13) 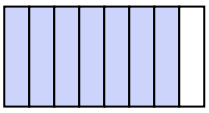

14) 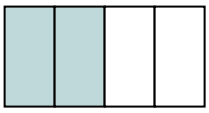

15) 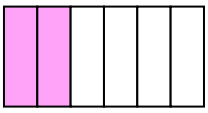

16) 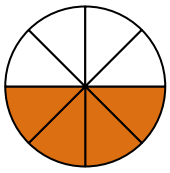

17) 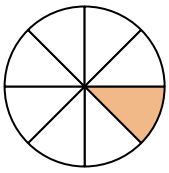

18) 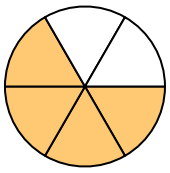

Ответы

1. $\frac{1}{6}$
2. $\frac{5}{8}$
3. $\frac{3}{6}$
4. $\frac{1}{4}$
5. $\frac{1}{2}$
6. $\frac{1}{3}$
7. $\frac{6}{8}$
8. $\frac{3}{4}$
9. $\frac{5}{6}$
10. $\frac{2}{8}$
11. $\frac{2}{3}$
12. $\frac{3}{8}$
13. $\frac{7}{8}$
14. $\frac{2}{4}$
15. $\frac{2}{6}$
16. $\frac{4}{8}$
17. $\frac{1}{8}$
18. $\frac{4}{6}$

1-10	94	89	83	78	72	67	61	56	50	44
11-18	39	33	28	22	17	11	6	0		

Написание дробей Имя:

Напишите дробь, равную закрашенной части в фигуре.

1)

2) 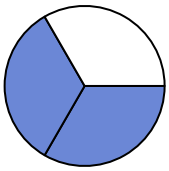

3) 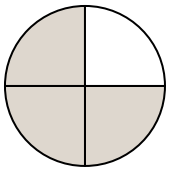

4) 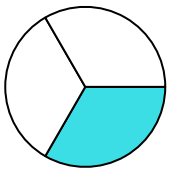

5) 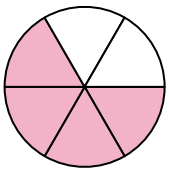

6) 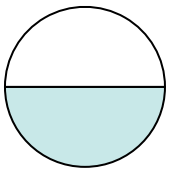

7) 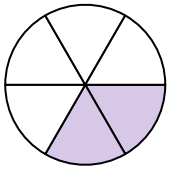

8) 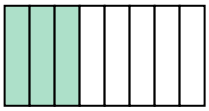

9)

10) 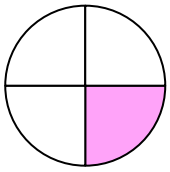

11)

12) 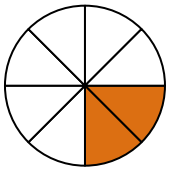

13) 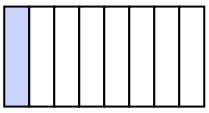

14) 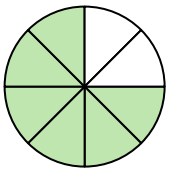

15) 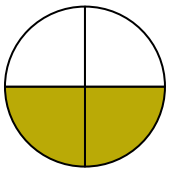

16) 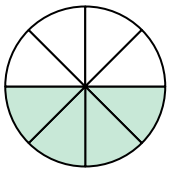

17) 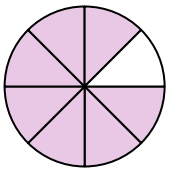

18) 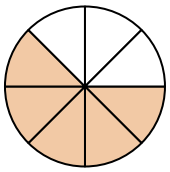

Ответы

1. _____
2. _____
3. _____
4. _____
5. _____
6. _____
7. _____
8. _____
9. _____
10. _____
11. _____
12. _____
13. _____
14. _____
15. _____
16. _____
17. _____
18. _____

1-10	94	89	83	78	72	67	61	56	50	44
11-18	39	33	28	22	17	11	6	0		

Написание дробей

Имя: **Ключ к правильным ответам**

Напишите дробь, равную закрашенной части в фигуре.

1)

2)
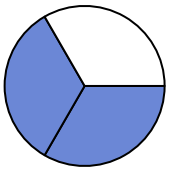

3)
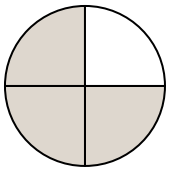

4)
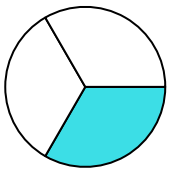

5)
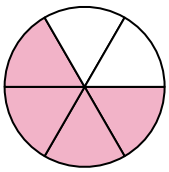

6)
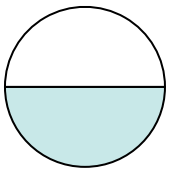

7)
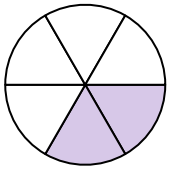

8)
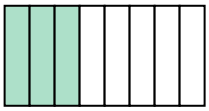

9)

10)
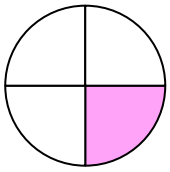

11)

12)
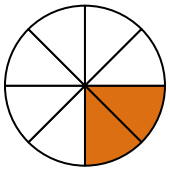

13)
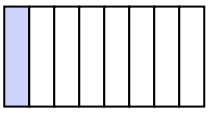

14)
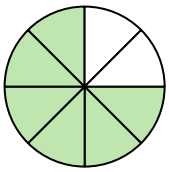

15)
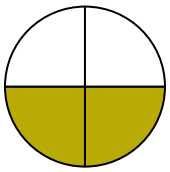

16)
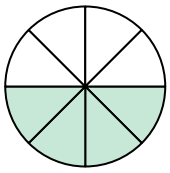

17)
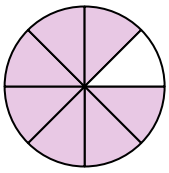

18)
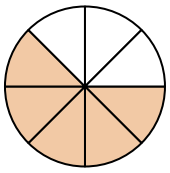

Ответы

1. $^{5}/_{6}$
2. $^{2}/_{3}$
3. $^{3}/_{4}$
4. $^{1}/_{3}$
5. $^{4}/_{6}$
6. $^{1}/_{2}$
7. $^{2}/_{6}$
8. $^{3}/_{8}$
9. $^{1}/_{6}$
10. $^{1}/_{4}$
11. $^{3}/_{6}$
12. $^{2}/_{8}$
13. $^{1}/_{8}$
14. $^{6}/_{8}$
15. $^{2}/_{4}$
16. $^{4}/_{8}$
17. $^{7}/_{8}$
18. $^{5}/_{8}$

1-10	94	89	83	78	72	67	61	56	50	44
11-18	39	33	28	22	17	11	6	0		

Написание дробей

Имя:

Напишите дробь, равную закрашенной части в фигуре.

1) 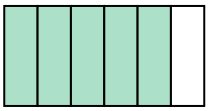

2)

3) 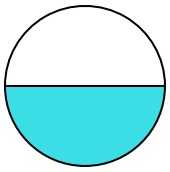

4) 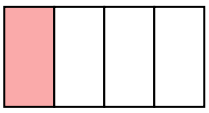

5) 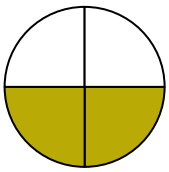

6) 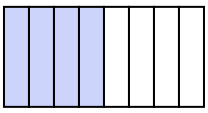

7) 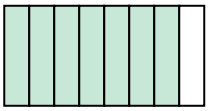

8) 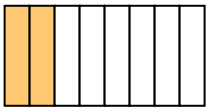

9) 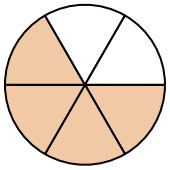

10) 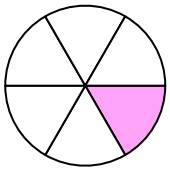

11) 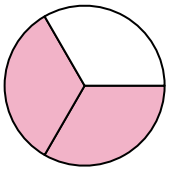

12) 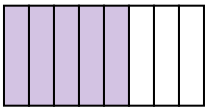

13) 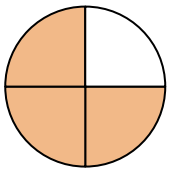

14) 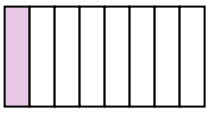

15) 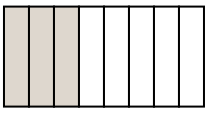

16) 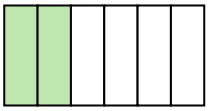

17) 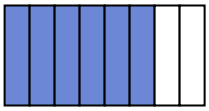

18) 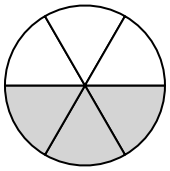

Ответы

1. _____
2. _____
3. _____
4. _____
5. _____
6. _____
7. _____
8. _____
9. _____
10. _____
11. _____
12. _____
13. _____
14. _____
15. _____
16. _____
17. _____
18. _____

1-10	94	89	83	78	72	67	61	56	50	44
11-18	39	33	28	22	17	11	6	0		

Написание дробей

Имя: **Ключ к правильным ответам**

Напишите дробь, равную закрашенной части в фигуре.

1) 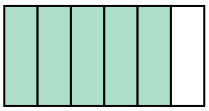

2)

3) 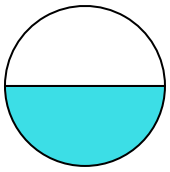

4) 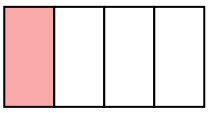

5) 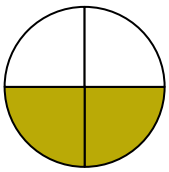

6) 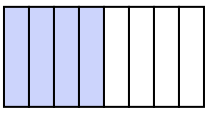

7) 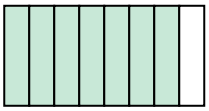

8) 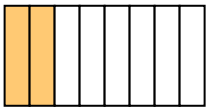

9) 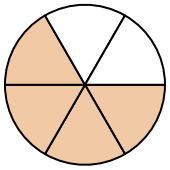

10) 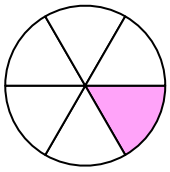

11) 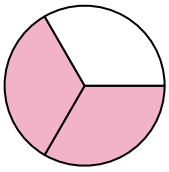

12) 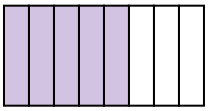

13) 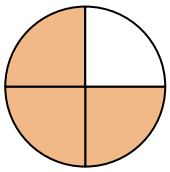

14) 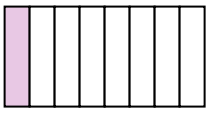

15) 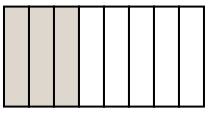

16) 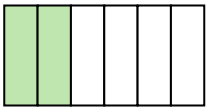

17) 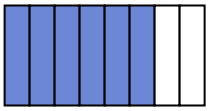

18) 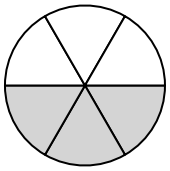

Ответы

1. $^{5}/_{6}$
2. $^{1}/_{3}$
3. $^{1}/_{2}$
4. $^{1}/_{4}$
5. $^{2}/_{4}$
6. $^{4}/_{8}$
7. $^{7}/_{8}$
8. $^{2}/_{8}$
9. $^{4}/_{6}$
10. $^{1}/_{6}$
11. $^{2}/_{3}$
12. $^{5}/_{8}$
13. $^{3}/_{4}$
14. $^{1}/_{8}$
15. $^{3}/_{8}$
16. $^{2}/_{6}$
17. $^{6}/_{8}$
18. $^{3}/_{6}$

1-10	94	89	83	78	72	67	61	56	50	44
11-18	39	33	28	22	17	11	6	0		

Написание дробей Имя:

Напишите дробь, равную закрашенной части в фигуре.

1) 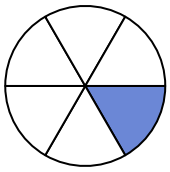

2) 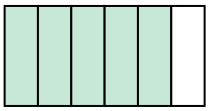

3) 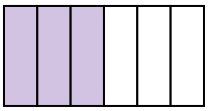

4) 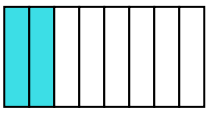

5) 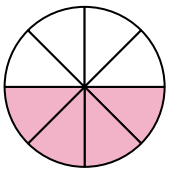

6) 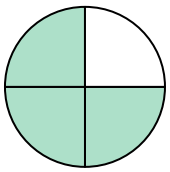

7)

8) 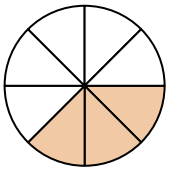

9) 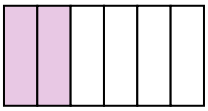

10) 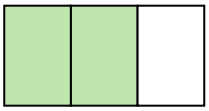

11) 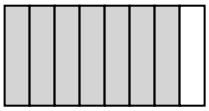

12) 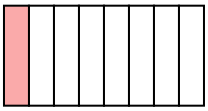

13) 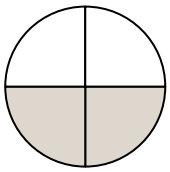

14) 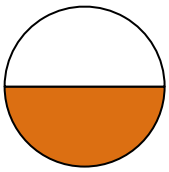

15) 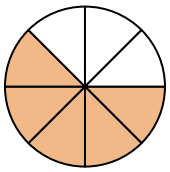

16) 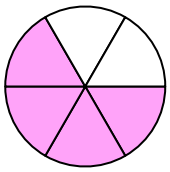

17) 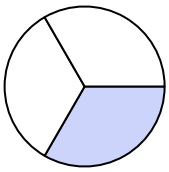

18) 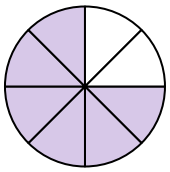

Ответы

1. _____
2. _____
3. _____
4. _____
5. _____
6. _____
7. _____
8. _____
9. _____
10. _____
11. _____
12. _____
13. _____
14. _____
15. _____
16. _____
17. _____
18. _____

1-10	94	89	83	78	72	67	61	56	50	44
11-18	39	33	28	22	17	11	6	0		

Написание дробей

Имя: **Ключ к правильным ответам**

Напишите дробь, равную закрашенной части в фигуре.

1)
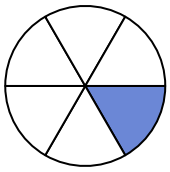

2)
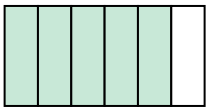

3)
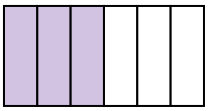

4)
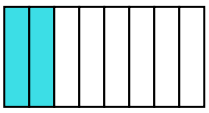

5)
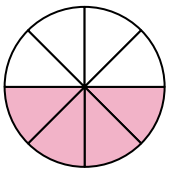

6)
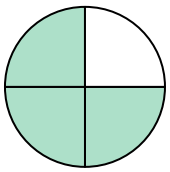

7)

8)
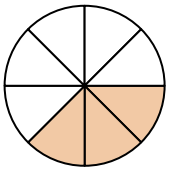

9)
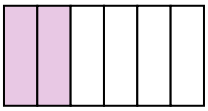

10)
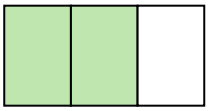

11)
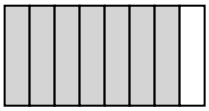

12)
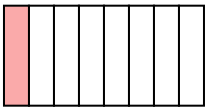

13)
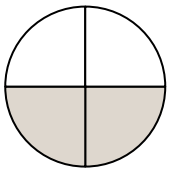

14)
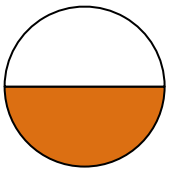

15)
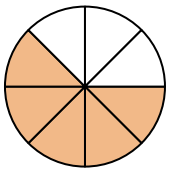

16)
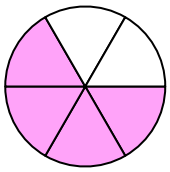

17)
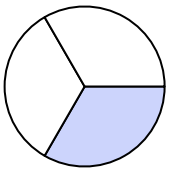

18)
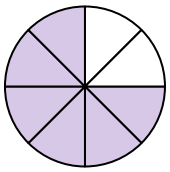

Ответы

1. $\frac{1}{6}$
2. $\frac{5}{6}$
3. $\frac{3}{6}$
4. $\frac{2}{8}$
5. $\frac{4}{8}$
6. $\frac{3}{4}$
7. $\frac{1}{4}$
8. $\frac{3}{8}$
9. $\frac{2}{6}$
10. $\frac{2}{3}$
11. $\frac{7}{8}$
12. $\frac{1}{8}$
13. $\frac{2}{4}$
14. $\frac{1}{2}$
15. $\frac{5}{8}$
16. $\frac{4}{6}$
17. $\frac{1}{3}$
18. $\frac{6}{8}$

1-10	94	89	83	78	72	67	61	56	50	44
11-18	39	33	28	22	17	11	6	0		

Написание дробей Имя:

Напишите дробь, равную закрашенной части в фигуре.

1) 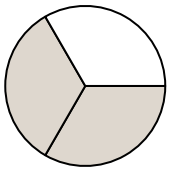

2) 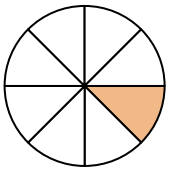

3) 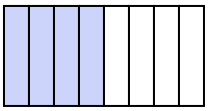

4) 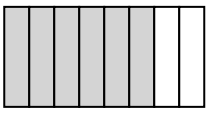

5) 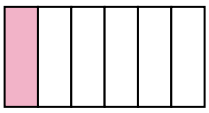

6) 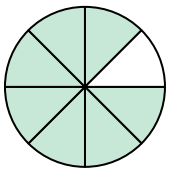

7) 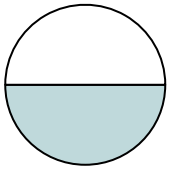

8) 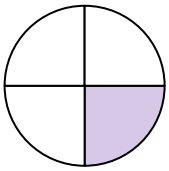

9) 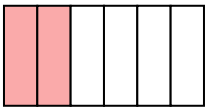

10) 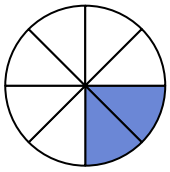

11) 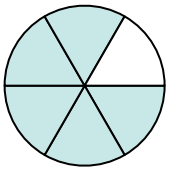

12) 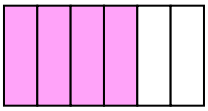

13) 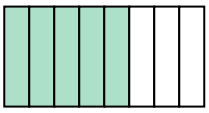

14) 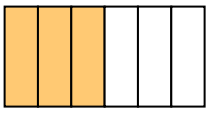

15) 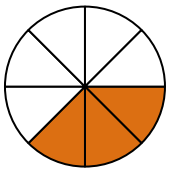

16)

17) 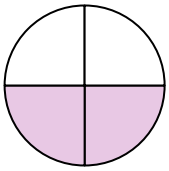

18) 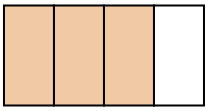

Ответы

1. _____
2. _____
3. _____
4. _____
5. _____
6. _____
7. _____
8. _____
9. _____
10. _____
11. _____
12. _____
13. _____
14. _____
15. _____
16. _____
17. _____
18. _____

1-10	94	89	83	78	72	67	61	56	50	44
11-18	39	33	28	22	17	11	6	0		

Написание дробей

Имя: **Ключ к правильным ответам**

Напишите дробь, равную закрашенной части в фигуре.

1)
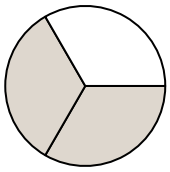

2)
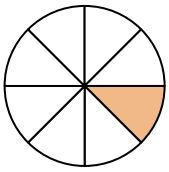

3)
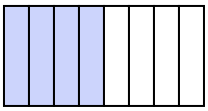

4)
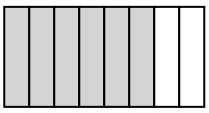

5)
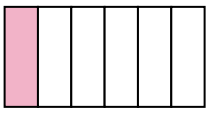

6)
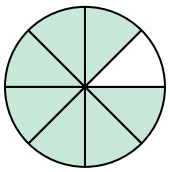

7)
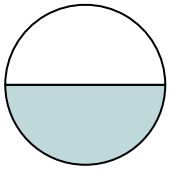

8)
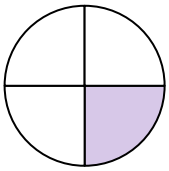

9)
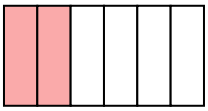

10)
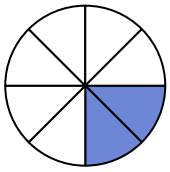

11)
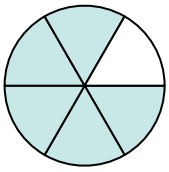

12)
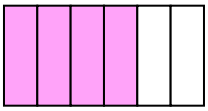

13)
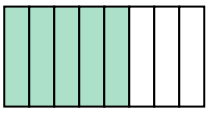

14)
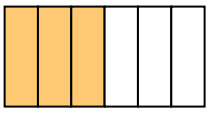

15)
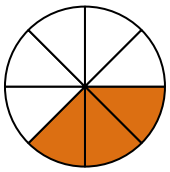

16)

17)
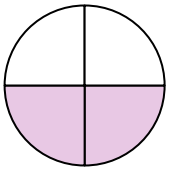

18)
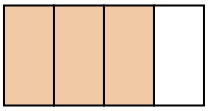

Ответы

1. $^{2}/_{3}$
2. $^{1}/_{8}$
3. $^{4}/_{8}$
4. $^{6}/_{8}$
5. $^{1}/_{6}$
6. $^{7}/_{8}$
7. $^{1}/_{2}$
8. $^{1}/_{4}$
9. $^{2}/_{6}$
10. $^{2}/_{8}$
11. $^{5}/_{6}$
12. $^{4}/_{6}$
13. $^{5}/_{8}$
14. $^{3}/_{6}$
15. $^{3}/_{8}$
16. $^{1}/_{3}$
17. $^{2}/_{4}$
18. $^{3}/_{4}$

1-10	94	89	83	78	72	67	61	56	50	44
11-18	39	33	28	22	17	11	6	0		

Написание дробей Имя:

Напишите дробь, равную закрашенной части в фигуре.

1) 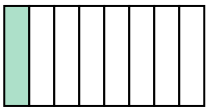

2) 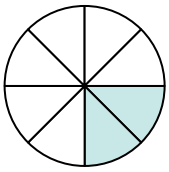

3) 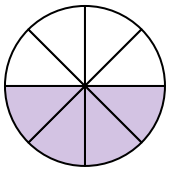

4) 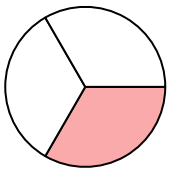

5) 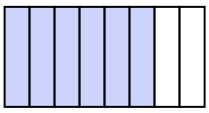

6) 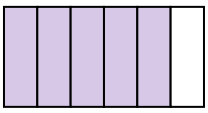

7) 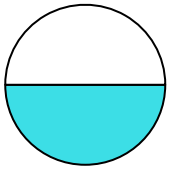

8) 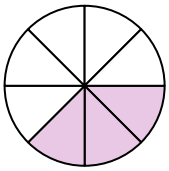

9)

10) 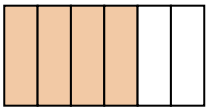

11) 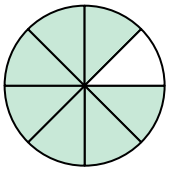

12) 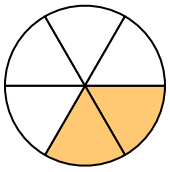

13) 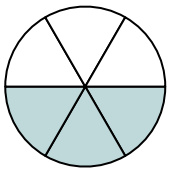

14) 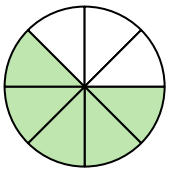

15) 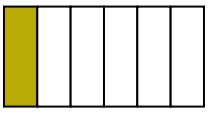

16) 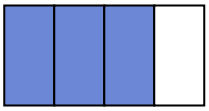

17) 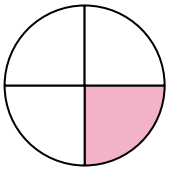

18) 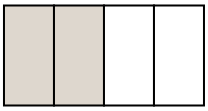

Ответы

1. _____
2. _____
3. _____
4. _____
5. _____
6. _____
7. _____
8. _____
9. _____
10. _____
11. _____
12. _____
13. _____
14. _____
15. _____
16. _____
17. _____
18. _____

1-10	94	89	83	78	72	67	61	56	50	44
11-18	39	33	28	22	17	11	6	0		

Написание дробей

Имя: **Ключ к правильным ответам**

Напишите дробь, равную закрашенной части в фигуре.

1) 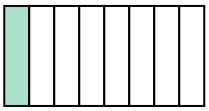

2) 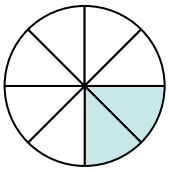

3) 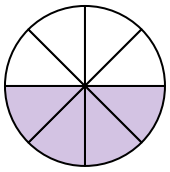

4) 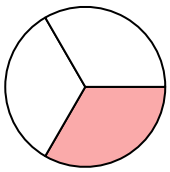

5) 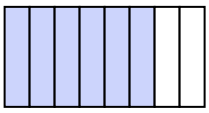

6) 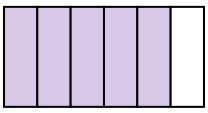

7) 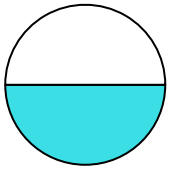

8) 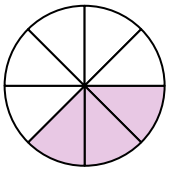

9)

10) 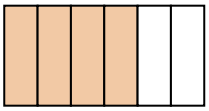

11) 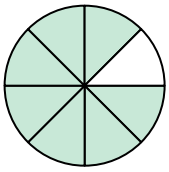

12) 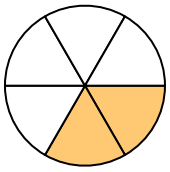

13) 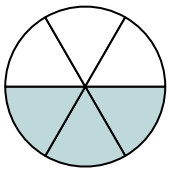

14) 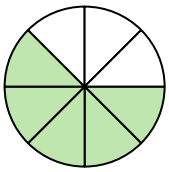

15) 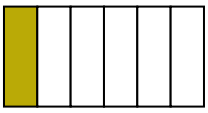

16) 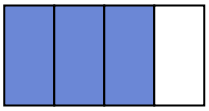

17) 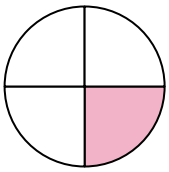

18) 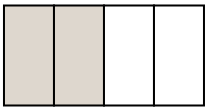

Ответы

1. $\frac{1}{8}$
2. $\frac{2}{8}$
3. $\frac{4}{8}$
4. $\frac{1}{3}$
5. $\frac{6}{8}$
6. $\frac{5}{6}$
7. $\frac{1}{2}$
8. $\frac{3}{8}$
9. $\frac{2}{3}$
10. $\frac{4}{6}$
11. $\frac{7}{8}$
12. $\frac{2}{6}$
13. $\frac{3}{6}$
14. $\frac{5}{8}$
15. $\frac{1}{6}$
16. $\frac{3}{4}$
17. $\frac{1}{4}$
18. $\frac{2}{4}$

1-10	94	89	83	78	72	67	61	56	50	44
11-18	39	33	28	22	17	11	6	0		

Написание дробей Имя:

Напишите дробь, равную закрашенной части в фигуре.

1) 

2) 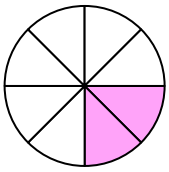

3) 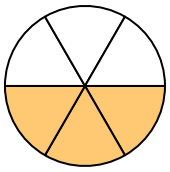

4) 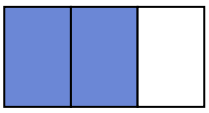

5) 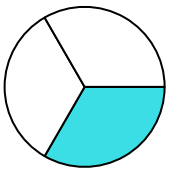

6) 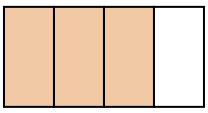

7) 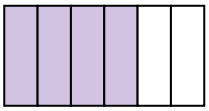

8)

9) 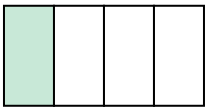

10) 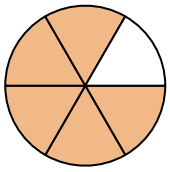

11) 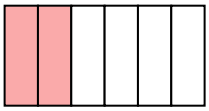

12) 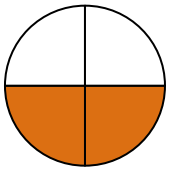

13) 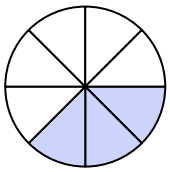

14) 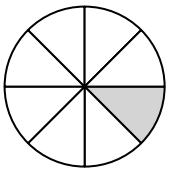

15) 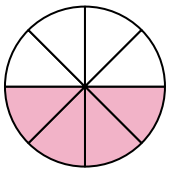

16) 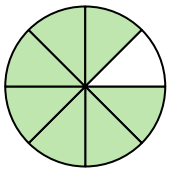

17) 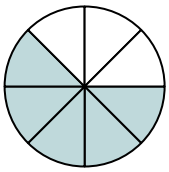

18) 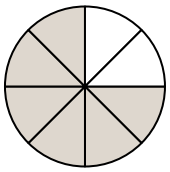

Ответы

1. _____
2. _____
3. _____
4. _____
5. _____
6. _____
7. _____
8. _____
9. _____
10. _____
11. _____
12. _____
13. _____
14. _____
15. _____
16. _____
17. _____
18. _____

1-10	94	89	83	78	72	67	61	56	50	44
11-18	39	33	28	22	17	11	6	0		

Написание дробей

Имя: **Ключ к правильным ответам**

Напишите дробь, равную закрашенной части в фигуре.

1) 

2) 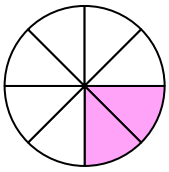

3) 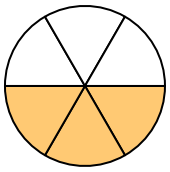

4) 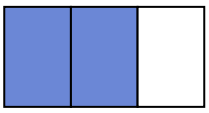

5) 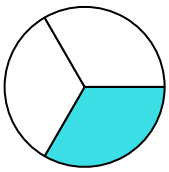

6) 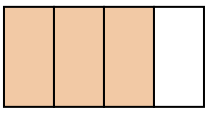

7) 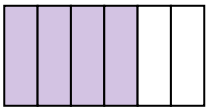

8)

9) 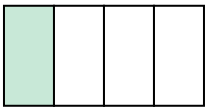

10) 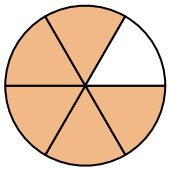

11) 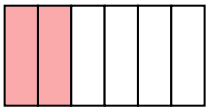

12) 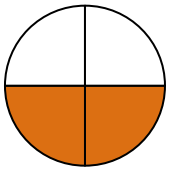

13) 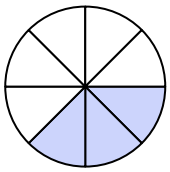

14) 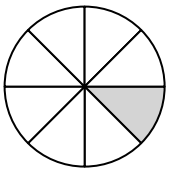

15) 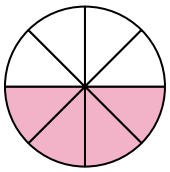

16) 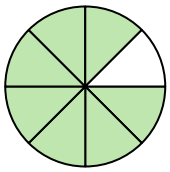

17) 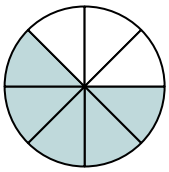

18) 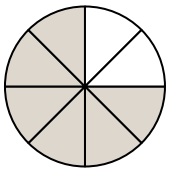

Ответы

1. $\frac{1}{2}$
2. $\frac{2}{8}$
3. $\frac{3}{6}$
4. $\frac{2}{3}$
5. $\frac{1}{3}$
6. $\frac{3}{4}$
7. $\frac{4}{6}$
8. $\frac{1}{6}$
9. $\frac{1}{4}$
10. $\frac{5}{6}$
11. $\frac{2}{6}$
12. $\frac{2}{4}$
13. $\frac{3}{8}$
14. $\frac{1}{8}$
15. $\frac{4}{8}$
16. $\frac{7}{8}$
17. $\frac{5}{8}$
18. $\frac{6}{8}$

1-10	94	89	83	78	72	67	61	56	50	44
11-18	39	33	28	22	17	11	6	0		

Написание дробей

Имя:

Напишите дробь, равную закрашенной части в фигуре.

1) 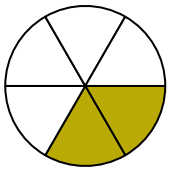

2) 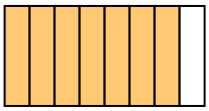

3) 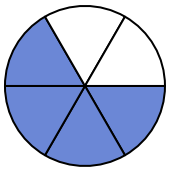

4) 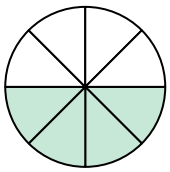

5) 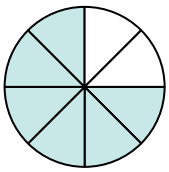

6) 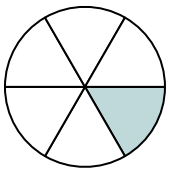

7)

8) 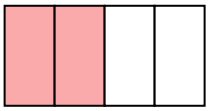

9) 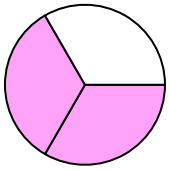

10) 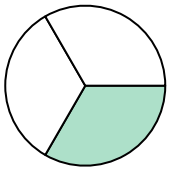

11) 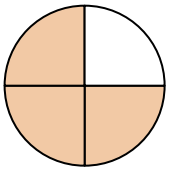

12) 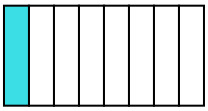

13) 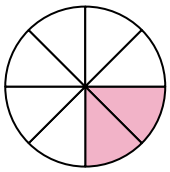

14) 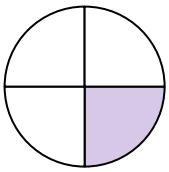

15) 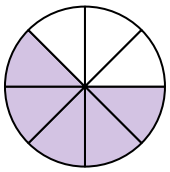

16) 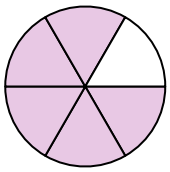

17) 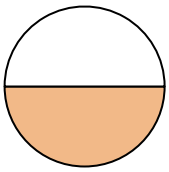

18) 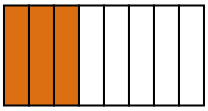

Ответы

1. _____
2. _____
3. _____
4. _____
5. _____
6. _____
7. _____
8. _____
9. _____
10. _____
11. _____
12. _____
13. _____
14. _____
15. _____
16. _____
17. _____
18. _____

1-10	94	89	83	78	72	67	61	56	50	44
11-18	39	33	28	22	17	11	6	0		

Написание дробей

Имя: **Ключ к правильным ответам**

Напишите дробь, равную закрашенной части в фигуре.

1)
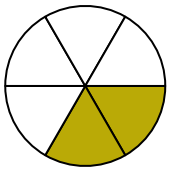

2)
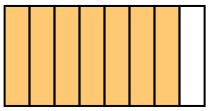

3)
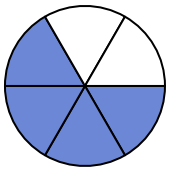

4)
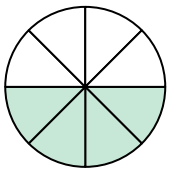

5)
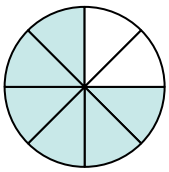

6)
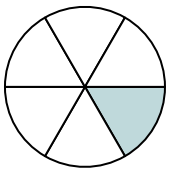

7)

8)
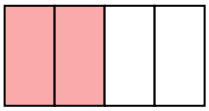

9)
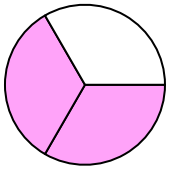

10)
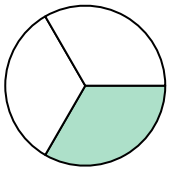

11)
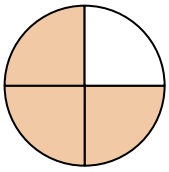

12)
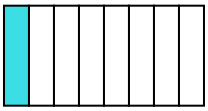

13)
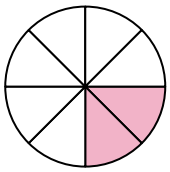

14)
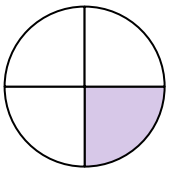

15)
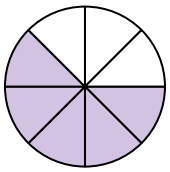

16)
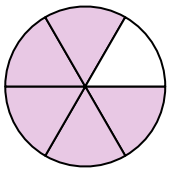

17)
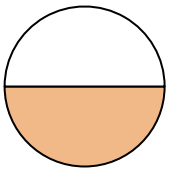

18)
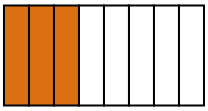

Ответы

1. $^{2}/_{6}$
2. $^{7}/_{8}$
3. $^{4}/_{6}$
4. $^{4}/_{8}$
5. $^{6}/_{8}$
6. $^{1}/_{6}$
7. $^{3}/_{6}$
8. $^{2}/_{4}$
9. $^{2}/_{3}$
10. $^{1}/_{3}$
11. $^{3}/_{4}$
12. $^{1}/_{8}$
13. $^{2}/_{8}$
14. $^{1}/_{4}$
15. $^{5}/_{8}$
16. $^{5}/_{6}$
17. $^{1}/_{2}$
18. $^{3}/_{8}$

1-10	94	89	83	78	72	67	61	56	50	44
11-18	39	33	28	22	17	11	6	0		