Определение того же наклона Имя:

Определите, какой вариант имеет тот же наклон, что и показанный.

1)

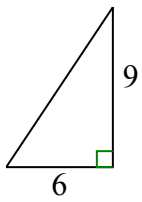

A.

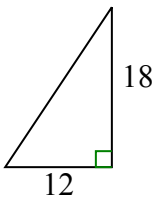

B.

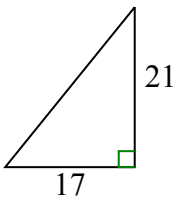

C.

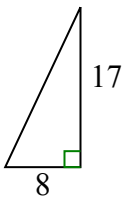

D.

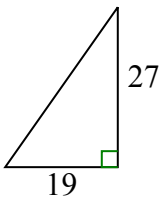

2)

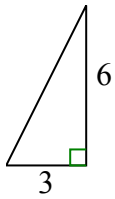

A.

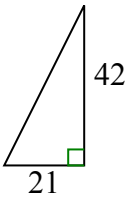

B.

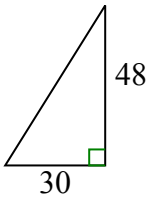

C.

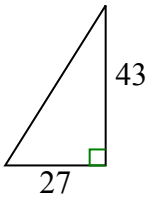

D.

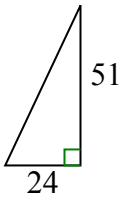

3)

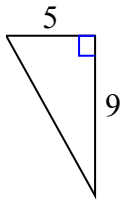

A.

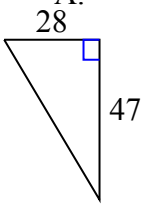

B.

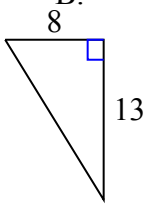

C.

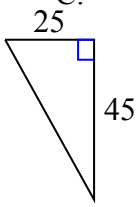

D.

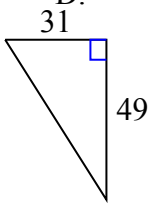

4)

A.

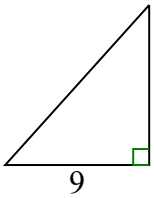

B.

C.

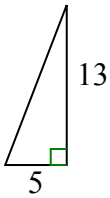

D.

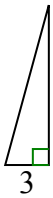

5)

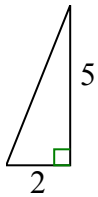

A.

B.

C.

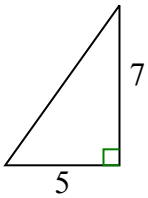

D.

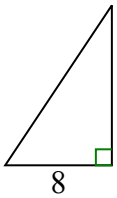

Ответы

1. _____
2. _____
3. _____
4. _____
5. _____

1-5	80	60	40	20	0

Определение того же наклона Имя: Ключ к правильным ответам

Определите, какой вариант имеет тот же наклон, что и показанный.

1)

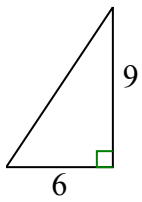

A.

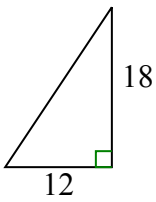

B.

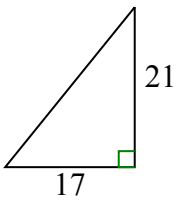

C.

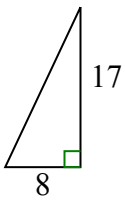

D.

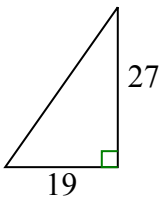

2)

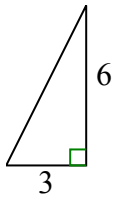

A.

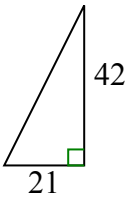

B.

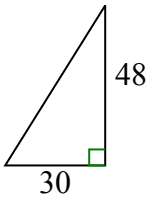

C.

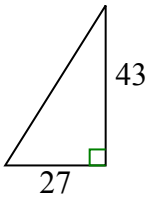

D.

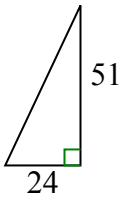

3)

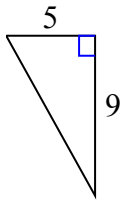

A.

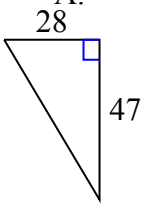

B.

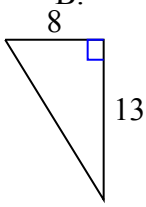

C.

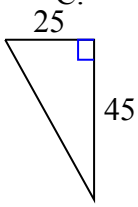

D.

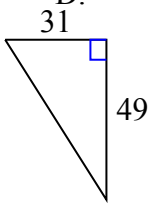

4)

A.

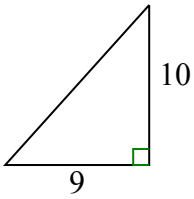

B.

C.

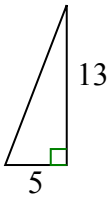

D.

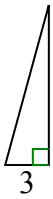

5)

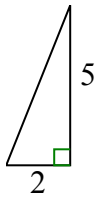

A.

B.

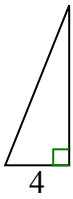

C.

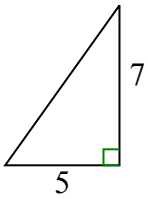

D.

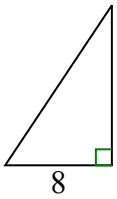

Ответы

1. A
2. A
3. C
4. B
5. B

1-5	80	60	40	20	0