Измерьте каждый ЭЛЕМЕНТ от наконечника до наконечника, затем поместите результаты на линейный график.

об)



1)

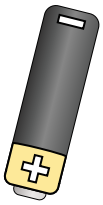

2)

3)

4)



5)

6)

7)

8)



9)

10)

11)

Line Plot							
¼	½	¾	1	1 ¼	1 ½	1 ¾	2

Ответы

об. 1 ½

1. _____

2. _____

3. _____

4. _____

5. _____

6. _____

7. _____

8. _____

9. _____

10. _____

11. _____

1-10	91	82	73	64	55	45	36	27	18	9
11	0									

Измерьте каждый ЭЛЕМЕНТ от наконечника до наконечника, затем поместите результаты на линейный график.

об)



1)

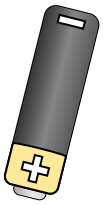

2)

3)

4)



5)

6)

7)

8)



9)

10)

11)

Line Plot

	X				X	X	X
X	X	X	X	X	X	X	X
¼	½	¾	1	1 ¼	1 ½	1 ¾	2

Ответы

об.	1 ½
1.	1
2.	1 ¾
3.	1 ¼
4.	¾
5.	2
6.	½
7.	¼
8.	2
9.	1 ½
10.	1 ¾
11.	½

1-10	91	82	73	64	55	45	36	27	18	9
11	0									