Измерение и отображение данных Имя:

Измерьте каждый ЭЛЕМЕНТ от наконечника до наконечника, затем поместите результаты на линейный график.

об) 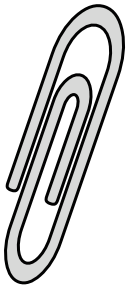

1) 

2) 

3) 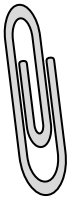

4) 

5)

6)

7) 

8)

9) 

10) 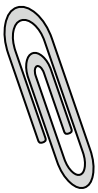

11)

Line Plot							
¼	½	¾	1	1 ¼	1 ½	1 ¾	2

Ответы

об. 1 ½

1. _____

2. _____

3. _____

4. _____

5. _____

6. _____

7. _____

8. _____

9. _____

10. _____

11. _____

1-10	91	82	73	64	55	45	36	27	18	9
11	0									

Измерьте каждый ЭЛЕМЕНТ от наконечника до наконечника, затем поместите результаты на линейный график.

об)

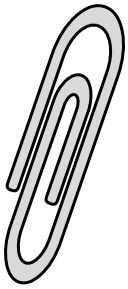

1)



2)



3)

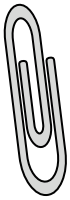

4)



5)

6)

7)



8)

9)



10)

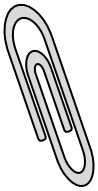

11)

Line Plot

X	X		X		X		
X	X	X	X	X	X	X	X
¼	½	¾	1	1 ¼	1 ½	1 ¾	2

Ответы

об.	1 ½
1.	1 ¾
2.	2
3.	1
4.	¾
5.	½
6.	¼
7.	1 ¼
8.	¼
9.	1 ½
10.	1
11.	½

1-10	91	82	73	64	55	45	36	27	18	9
11	0									