Написание задач на умножение Имя:

Определите, как нужно изобразить численно данные задачи.

об)



1)

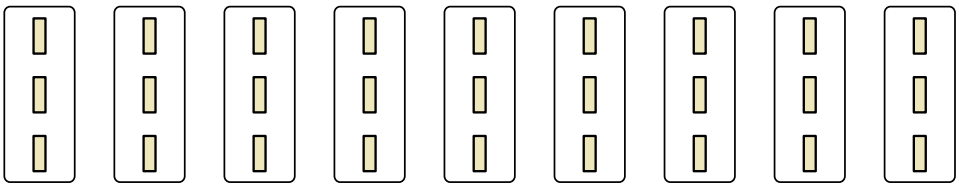

2)



3)



4)

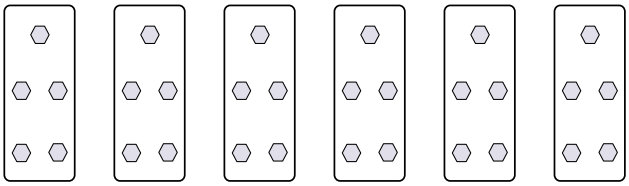

5)

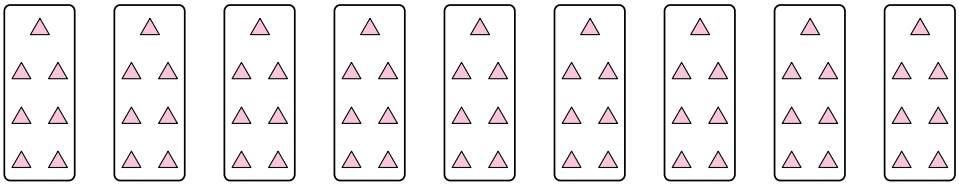

6)

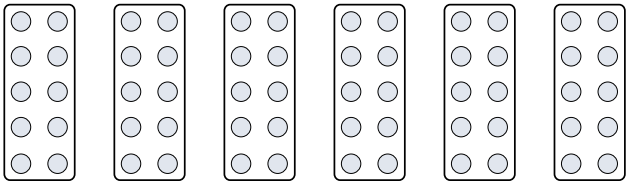

7)

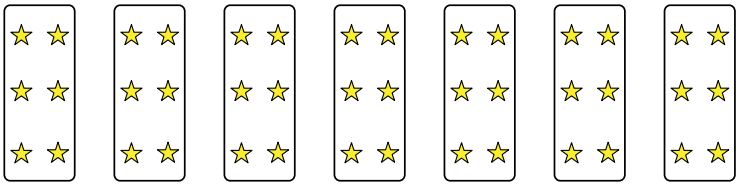

8)

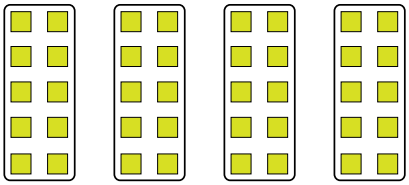

Ответы

об. 7×9=63

1. _____

2. _____

3. _____

4. _____

5. _____

6. _____

7. _____

8. _____

1-8	88	75	63	50	38	25	13	0

Написание задач на умножение

Имя: Ключ к правильным ответам

Определите, как нужно изобразить численно данные задачи.

об)



1)

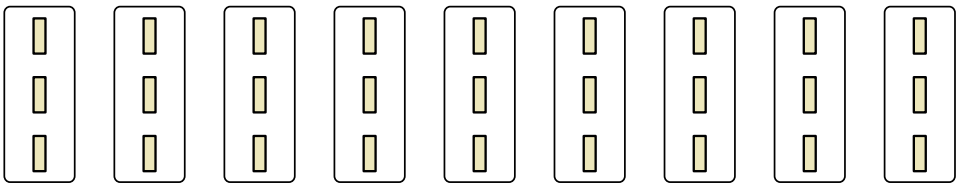

2)



3)



4)

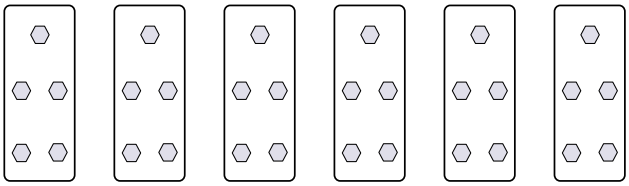

5)

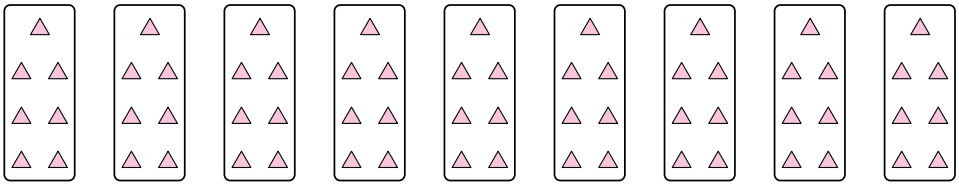

6)

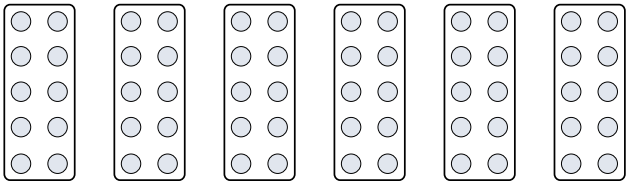

7)

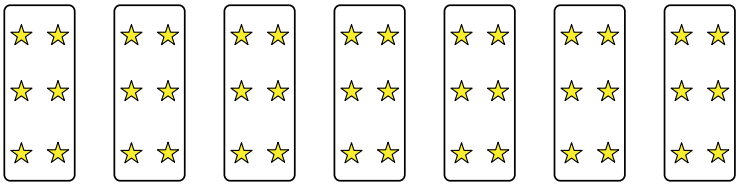

8)

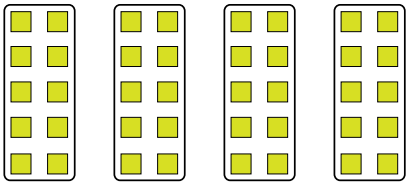

Ответы

об. 7×9=63

1. 9×3=27

2. 6×2=12

3. 9×4=36

4. 6×5=30

5. 9×7=63

6. 6×10=60

7. 7×6=42

8. 4×10=40

1-8	88	75	63	50	38	25	13	0