Написание задач на умножение (визуальное) Имя:

Перепишите каждую матрицу в виде умножения и решите.

об)



1)

2)

3)



4)

5)

6)

7)

8)



9)

10)



11)

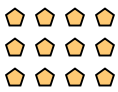

Ответы

об. **8 × 5 = 40**

1. _____

2. _____

3. _____

4. _____

5. _____

6. _____

7. _____

8. _____

9. _____

10. _____

11. _____

1-10	91	82	73	64	55	45	36	27	18	9
11	0									

Написание задач на умножение (визуальное) Имя: Ключ к правильным ответам

Перепишите каждую матрицу в виде умножения и решите.

об)



1)

2)

3)



4)

5)

6)

7)

8)



9)

10)



11)

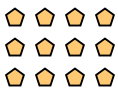

Ответы

об. 8 × 5 = 40

1. 9 × 3 = 27

2. 4 × 5 = 20

3. 5 × 8 = 40

4. 10 × 2 = 20

5. 5 × 6 = 30

6. 9 × 5 = 45

7. 8 × 2 = 16

8. 7 × 8 = 56

9. 2 × 4 = 8

10. 10 × 4 = 40

11. 3 × 4 = 12

1-10	91	82	73	64	55	45	36	27	18	9
11	0									