Написание задач на умножение (визуальное) Имя:

Перепишите каждую матрицу в виде умножения и решите.

об)



1)



2)

3)



4)

5)



6)

7)

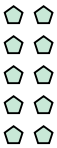

8)

9)

10)



11)

Ответы

об. 10 × 10 = 100

1. _____

2. _____

3. _____

4. _____

5. _____

6. _____

7. _____

8. _____

9. _____

10. _____

11. _____

1-10	91	82	73	64	55	45	36	27	18	9
11	0									

Написание задач на умножение (визуальное) Имя: **Ключ к правильным ответам**

Перепишите каждую матрицу в виде умножения и решите.

об)



1)



2)

3)



4)

5)



6)

7)

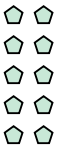

8)

9)

10)



11)

Ответы

об. 10 × 10 = 100

1. 10 × 7 = 70

2. 4 × 7 = 28

3. 10 × 6 = 60

4. 8 × 2 = 16

5. 3 × 6 = 18

6. 6 × 2 = 12

7. 5 × 2 = 10

8. 5 × 7 = 35

9. 5 × 5 = 25

10. 9 × 9 = 81

11. 3 × 8 = 24

1-10	91	82	73	64	55	45	36	27	18	9
11	0									