Определение четырехугольников Имя:

Определите, изображен ли четырехугольник или нет. (да или нет)

1) 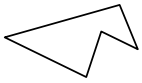

2) 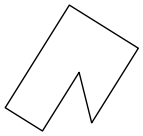

3) 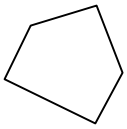

4) 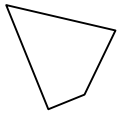

5) 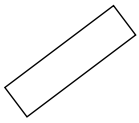

6) 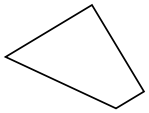

7)

8) 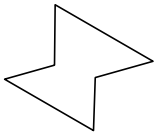

9) 

10) 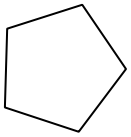

11) 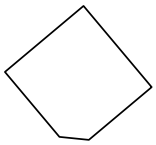

12) 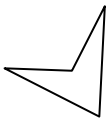

13)

14) 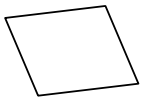

15) 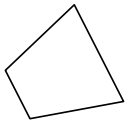

16) 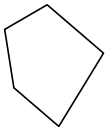

17) 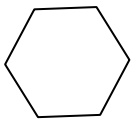

18) 

19) 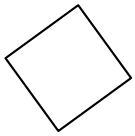

20) 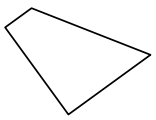

Ответы

1. _____
2. _____
3. _____
4. _____
5. _____
6. _____
7. _____
8. _____
9. _____
10. _____
11. _____
12. _____
13. _____
14. _____
15. _____
16. _____
17. _____
18. _____
19. _____
20. _____

1-10	95	90	85	80	75	70	65	60	55	50
11-20	45	40	35	30	25	20	15	10	5	0

Определение четырехугольников Имя: Ключ к правильным ответам

Определите, изображен ли четырехугольник или нет. (да или нет)

1) 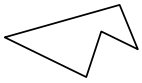

2) 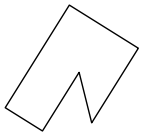

3) 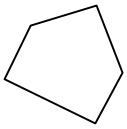

4) 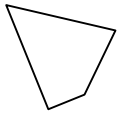

5) 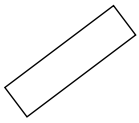

6) 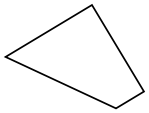

7)

8) 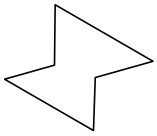

9) 

10) 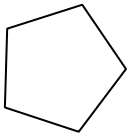

11) 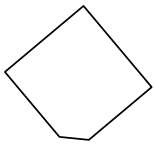

12) 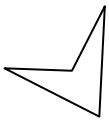

13)

14) 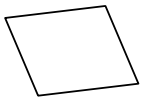

15) 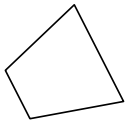

16) 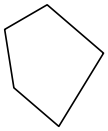

17) 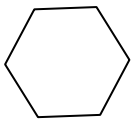

18) 

19) 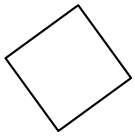

20) 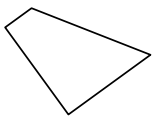

Ответы

1. нет
2. нет
3. нет
4. да
5. да
6. да
7. да
8. нет
9. нет
10. нет
11. нет
12. да
13. да
14. да
15. да
16. нет
17. нет
18. нет
19. да
20. да

1-10	95	90	85	80	75	70	65	60	55	50
11-20	45	40	35	30	25	20	15	10	5	0

Определение четырехугольников Имя:

Определите, изображен ли четырехугольник или нет. (да или нет)

1) 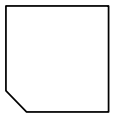

2)

3) 

4) 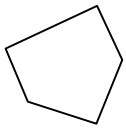

5)

6)

7)

8) 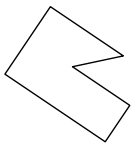

9)

10) 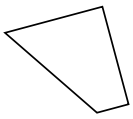

11) 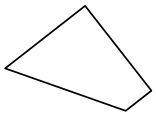

12) 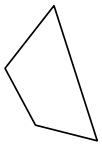

13) 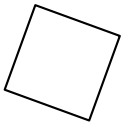

14)

15) 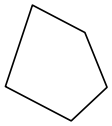

16) 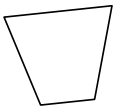

17) 

18) 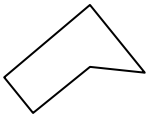

19) 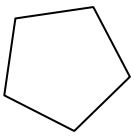

20) 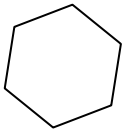

Ответы

1. _____
2. _____
3. _____
4. _____
5. _____
6. _____
7. _____
8. _____
9. _____
10. _____
11. _____
12. _____
13. _____
14. _____
15. _____
16. _____
17. _____
18. _____
19. _____
20. _____

1-10	95	90	85	80	75	70	65	60	55	50
11-20	45	40	35	30	25	20	15	10	5	0

Определение четырехугольников Имя: Ключ к правильным ответам

Определите, изображен ли четырехугольник или нет. (да или нет)

1) 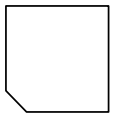

2)

3) 

4) 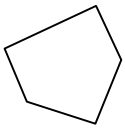

5)

6)

7)

8) 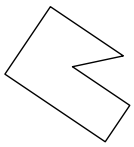

9)

10) 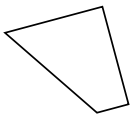

11) 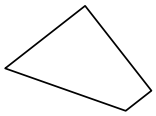

12) 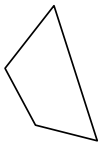

13) 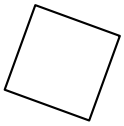

14) 

15) 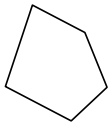

16) 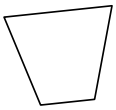

17) 

18) 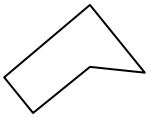

19) 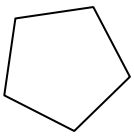

20) 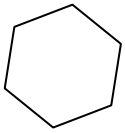

Ответы

1. нет
2. нет
3. да
4. нет
5. да
6. нет
7. да
8. нет
9. да
10. да
11. да
12. да
13. да
14. нет
15. нет
16. да
17. да
18. нет
19. нет
20. нет

1-10	95	90	85	80	75	70	65	60	55	50
11-20	45	40	35	30	25	20	15	10	5	0

Определение четырехугольников Имя:

Определите, изображен ли четырехугольник или нет. (да или нет)

1) 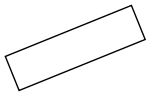

2)

3) 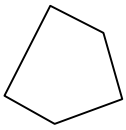

4)

5) 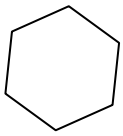

6) 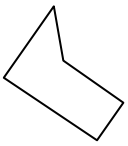

7) 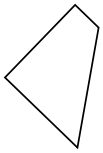

8) 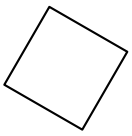

9) 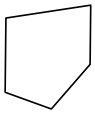

10) 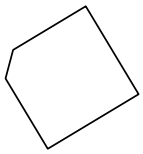

11) 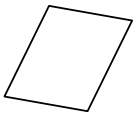

12) 

13) 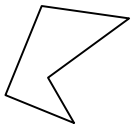

14) 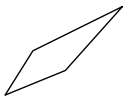

15) 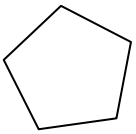

16) 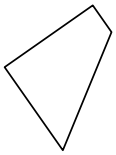

17) 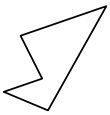

18) 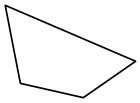

19) 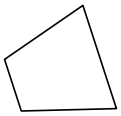

20) 

Ответы

1. _____
2. _____
3. _____
4. _____
5. _____
6. _____
7. _____
8. _____
9. _____
10. _____
11. _____
12. _____
13. _____
14. _____
15. _____
16. _____
17. _____
18. _____
19. _____
20. _____

1-10	95	90	85	80	75	70	65	60	55	50
11-20	45	40	35	30	25	20	15	10	5	0

Определение четырехугольников Имя: Ключ к правильным ответам

Определите, изображен ли четырехугольник или нет. (да или нет)

1) 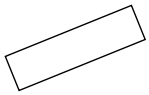

2)

3) 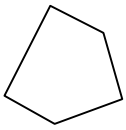

4)

5) 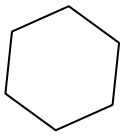

6) 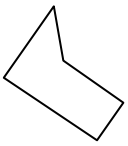

7) 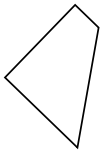

8) 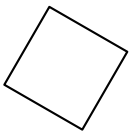

9) 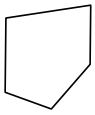

10) 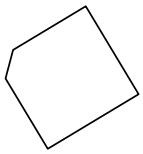

11) 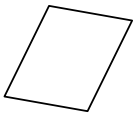

12) 

13) 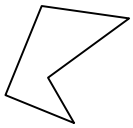

14) 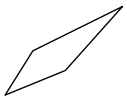

15) 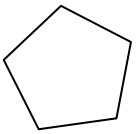

16) 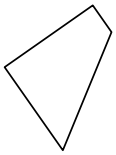

17) 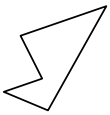

18) 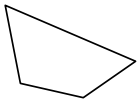

19) 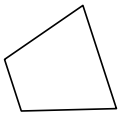

20) 

Ответы

1. да
2. нет
3. нет
4. да
5. нет
6. нет
7. да
8. да
9. нет
10. нет
11. да
12. да
13. нет
14. да
15. нет
16. да
17. нет
18. да
19. да
20. нет

1-10	95	90	85	80	75	70	65	60	55	50
11-20	45	40	35	30	25	20	15	10	5	0

Определение четырехугольников Имя:

Определите, изображен ли четырехугольник или нет. (да или нет)

1) 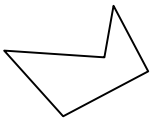

2) 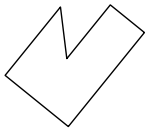

3) 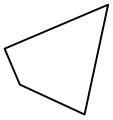

4) 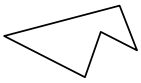

5) 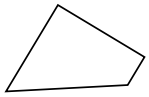

6) 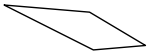

7) 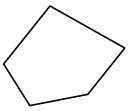

8) 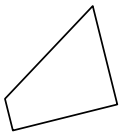

9) 

10) 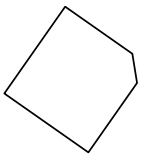

11) 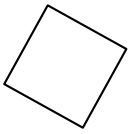

12) 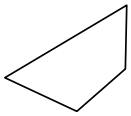

13) 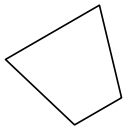

14) 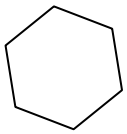

15) 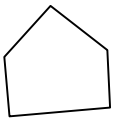

16) 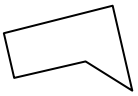

17) 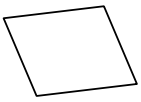

18) 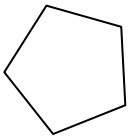

19) 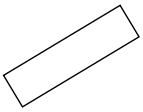

20)

Ответы

1. _____
2. _____
3. _____
4. _____
5. _____
6. _____
7. _____
8. _____
9. _____
10. _____
11. _____
12. _____
13. _____
14. _____
15. _____
16. _____
17. _____
18. _____
19. _____
20. _____

1-10	95	90	85	80	75	70	65	60	55	50
11-20	45	40	35	30	25	20	15	10	5	0

Определение четырехугольников Имя: Ключ к правильным ответам

Определите, изображен ли четырехугольник или нет. (да или нет)

1) 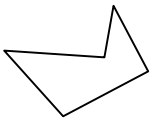

2) 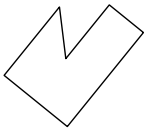

3) 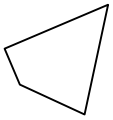

4) 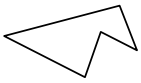

5) 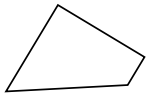

6) 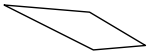

7) 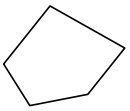

8) 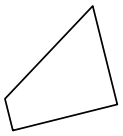

9) 

10) 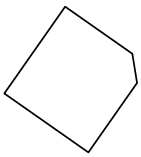

11) 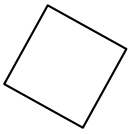

12) 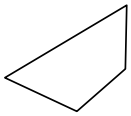

13) 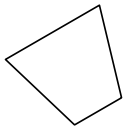

14) 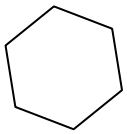

15) 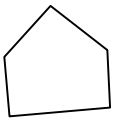

16) 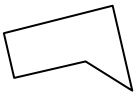

17) 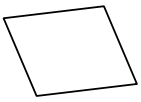

18) 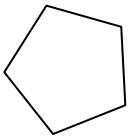

19) 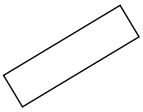

20)

Ответы

1. нет
2. нет
3. да
4. нет
5. да
6. да
7. нет
8. да
9. нет
10. нет
11. да
12. да
13. да
14. нет
15. нет
16. нет
17. да
18. нет
19. да
20. да

1-10	95	90	85	80	75	70	65	60	55	50
11-20	45	40	35	30	25	20	15	10	5	0

Определение четырехугольников Имя:

Определите, изображен ли четырехугольник или нет. (да или нет)

1) 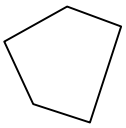

2) 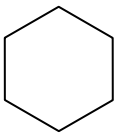

3) 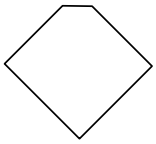

4) 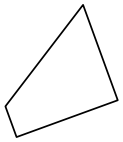

5) 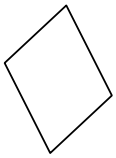

6) 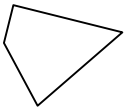

7) 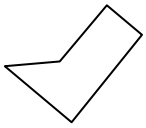

8) 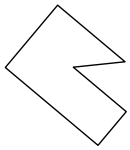

9) 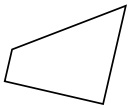

10) 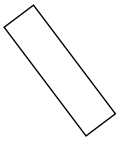

11) 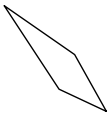

12) 

13) 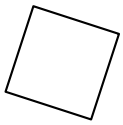

14)

15) 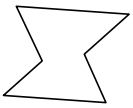

16) 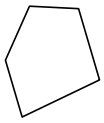

17) 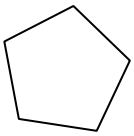

18)

19) 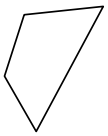

20) 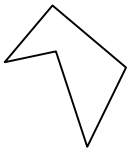

Ответы

1. _____
2. _____
3. _____
4. _____
5. _____
6. _____
7. _____
8. _____
9. _____
10. _____
11. _____
12. _____
13. _____
14. _____
15. _____
16. _____
17. _____
18. _____
19. _____
20. _____

1-10	95	90	85	80	75	70	65	60	55	50
11-20	45	40	35	30	25	20	15	10	5	0

Определение четырехугольников Имя: Ключ к правильным ответам

Определите, изображен ли четырехугольник или нет. (да или нет)

1) 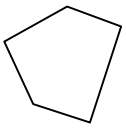

2) 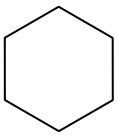

3) 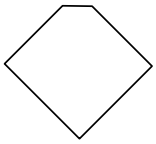

4) 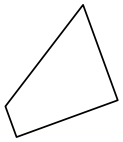

5) 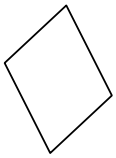

6) 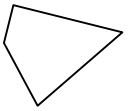

7) 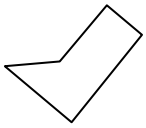

8) 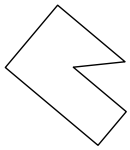

9) 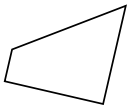

10) 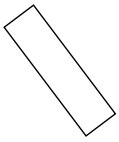

11) 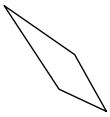

12) 

13) 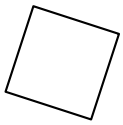

14)

15) 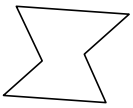

16) 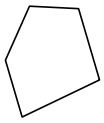

17) 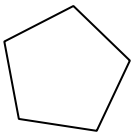

18)

19) 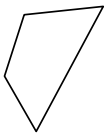

20) 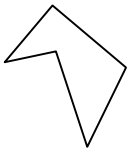

Ответы

1. нет
2. нет
3. нет
4. да
5. да
6. да
7. нет
8. нет
9. да
10. да
11. да
12. да
13. да
14. нет
15. нет
16. нет
17. нет
18. да
19. да
20. нет

1-10	95	90	85	80	75	70	65	60	55	50
11-20	45	40	35	30	25	20	15	10	5	0

Определение четырехугольников Имя:

Определите, изображен ли четырехугольник или нет. (да или нет)

1) 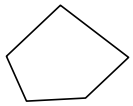

2) 

3) 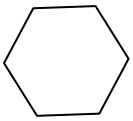

4) 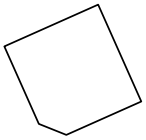

5)

6) 

7) 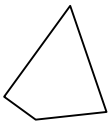

8) 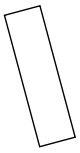

9) 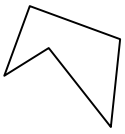

10) 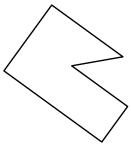

11) 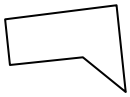

12) 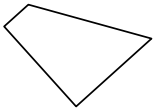

13) 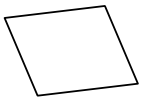

14) 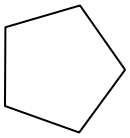

15) 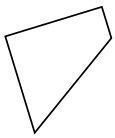

16) 

17) 

18)

19) 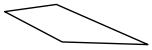

20) 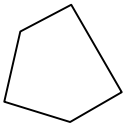

Ответы

1. _____
2. _____
3. _____
4. _____
5. _____
6. _____
7. _____
8. _____
9. _____
10. _____
11. _____
12. _____
13. _____
14. _____
15. _____
16. _____
17. _____
18. _____
19. _____
20. _____

1-10	95	90	85	80	75	70	65	60	55	50
11-20	45	40	35	30	25	20	15	10	5	0

Определение четырехугольников Имя: Ключ к правильным ответам

Определите, изображен ли четырехугольник или нет. (да или нет)

1) 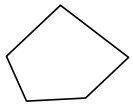

2) 

3) 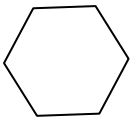

4) 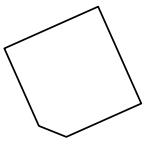

5)

6) 

7) 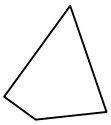

8) 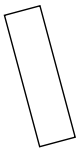

9) 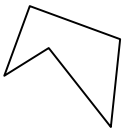

10) 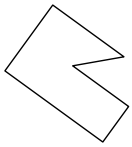

11) 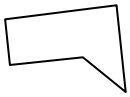

12) 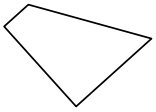

13) 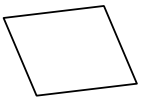

14) 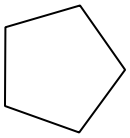

15) 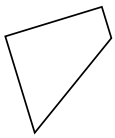

16) 

17) 

18)

19) 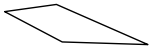

20) 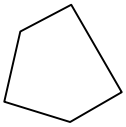

Ответы

1. нет
2. да
3. нет
4. нет
5. нет
6. да
7. да
8. да
9. нет
10. нет
11. нет
12. да
13. да
14. нет
15. да
16. нет
17. да
18. да
19. да
20. нет

1-10	95	90	85	80	75	70	65	60	55	50
11-20	45	40	35	30	25	20	15	10	5	0

Определение четырехугольников Имя:

Определите, изображен ли четырехугольник или нет. (да или нет)

1) 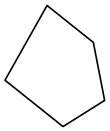

2) 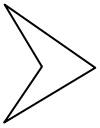

3)

4) 

5)

6) 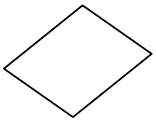

7) 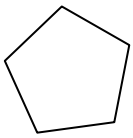

8) 

9) 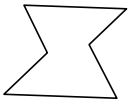

10)

11) 

12)

13) 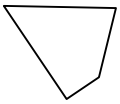

14)

15) 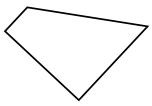

16) 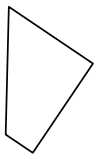

17)

18) 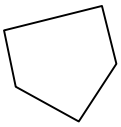

19) 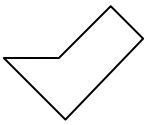

20) 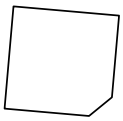

Ответы

1. _____
2. _____
3. _____
4. _____
5. _____
6. _____
7. _____
8. _____
9. _____
10. _____
11. _____
12. _____
13. _____
14. _____
15. _____
16. _____
17. _____
18. _____
19. _____
20. _____

1-10	95	90	85	80	75	70	65	60	55	50
11-20	45	40	35	30	25	20	15	10	5	0

Определение четырехугольников Имя: Ключ к правильным ответам

Определите, изображен ли четырехугольник или нет. (да или нет)

1) 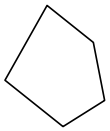

2) 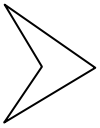

3)

4) 

5)

6) 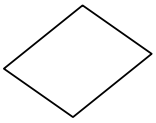

7) 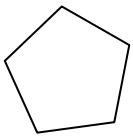

8) 

9) 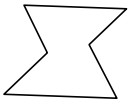

10)

11) 

12)

13) 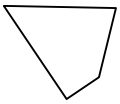

14)

15) 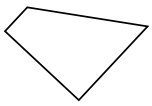

16) 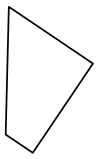

17)

18) 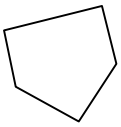

19) 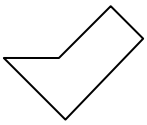

20) 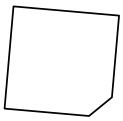

Ответы

1. нет
2. да
3. нет
4. да
5. нет
6. да
7. нет
8. да
9. нет
10. да
11. нет
12. да
13. да
14. да
15. да
16. да
17. нет
18. нет
19. нет
20. нет

1-10	95	90	85	80	75	70	65	60	55	50
11-20	45	40	35	30	25	20	15	10	5	0

Определение четырехугольников Имя:

Определите, изображен ли четырехугольник или нет. (да или нет)

1)

2) 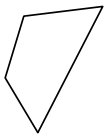

3) 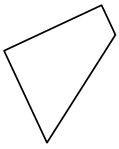

4) 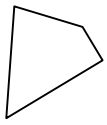

5) 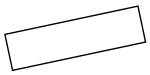

6) 

7) 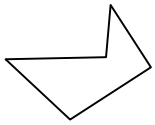

8) 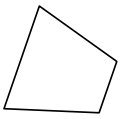

9) 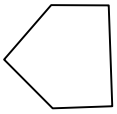

10) 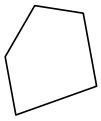

11) 

12) 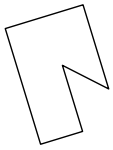

13) 

14) 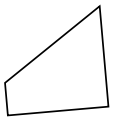

15) 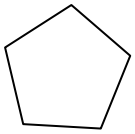

16) 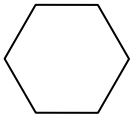

17)

18) 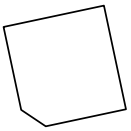

19)

20) 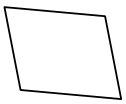

Ответы

1. _____
2. _____
3. _____
4. _____
5. _____
6. _____
7. _____
8. _____
9. _____
10. _____
11. _____
12. _____
13. _____
14. _____
15. _____
16. _____
17. _____
18. _____
19. _____
20. _____

1-10	95	90	85	80	75	70	65	60	55	50
11-20	45	40	35	30	25	20	15	10	5	0

Определение четырехугольников Имя: Ключ к правильным ответам

Определите, изображен ли четырехугольник или нет. (да или нет)

1)

2) 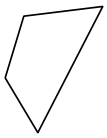

3) 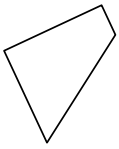

4) 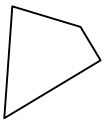

5) 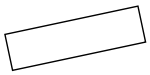

6) 

7) 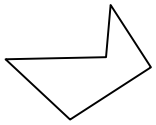

8) 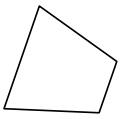

9) 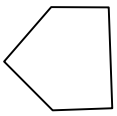

10) 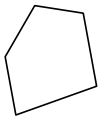

11) 

12) 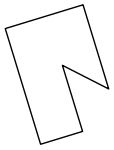

13) 

14) 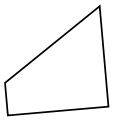

15) 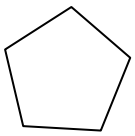

16) 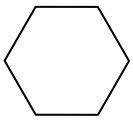

17)

18) 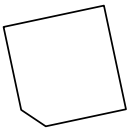

19)

20) 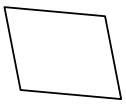

Ответы

1. да
2. да
3. да
4. да
5. да
6. нет
7. нет
8. да
9. нет
10. нет
11. нет
12. нет
13. да
14. да
15. нет
16. нет
17. нет
18. нет
19. да
20. да

1-10	95	90	85	80	75	70	65	60	55	50
11-20	45	40	35	30	25	20	15	10	5	0

Определение четырехугольников Имя:

Определите, изображен ли четырехугольник или нет. (да или нет)

1) 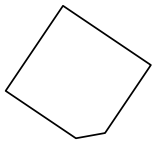

2) 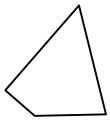

3) 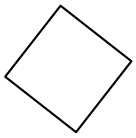

4) 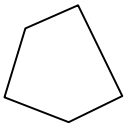

5)

6) 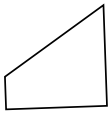

7) 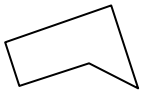

8) 

9) 

10) 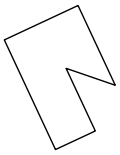

11) 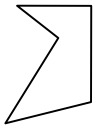

12)

13) 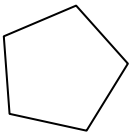

14) 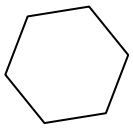

15) 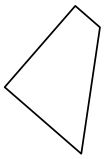

16) 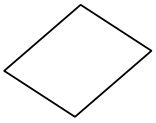

17) 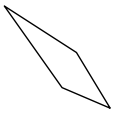

18) 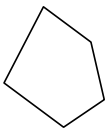

19)

20) 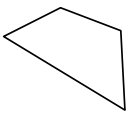

Ответы

1. _____
2. _____
3. _____
4. _____
5. _____
6. _____
7. _____
8. _____
9. _____
10. _____
11. _____
12. _____
13. _____
14. _____
15. _____
16. _____
17. _____
18. _____
19. _____
20. _____

1-10	95	90	85	80	75	70	65	60	55	50
11-20	45	40	35	30	25	20	15	10	5	0

Определение четырехугольников Имя: Ключ к правильным ответам

Определите, изображен ли четырехугольник или нет. (да или нет)

1) 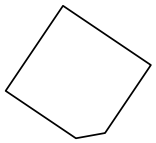

2) 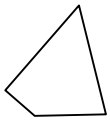

3) 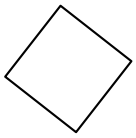

4) 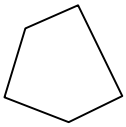

5)

6) 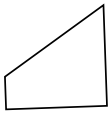

7) 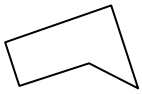

8) 

9) 

10) 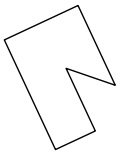

11) 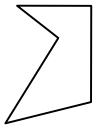

12)

13) 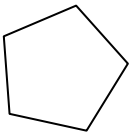

14) 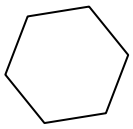

15) 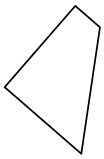

16) 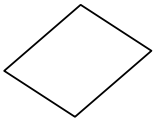

17) 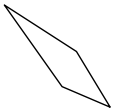

18) 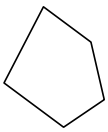

19)

20) 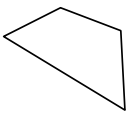

Ответы

1. нет
2. да
3. да
4. нет
5. да
6. да
7. нет
8. да
9. нет
10. нет
11. нет
12. нет
13. нет
14. нет
15. да
16. да
17. да
18. нет
19. да
20. да

1-10	95	90	85	80	75	70	65	60	55	50
11-20	45	40	35	30	25	20	15	10	5	0

Определение четырехугольников Имя:

Определите, изображен ли четырехугольник или нет. (да или нет)

1)

2) 

3) 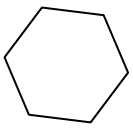

4) 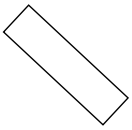

5) 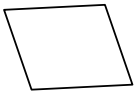

6) 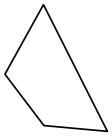

7) 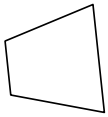

8) 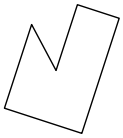

9)

10) 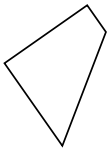

11)

12) 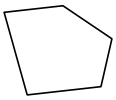

13) 

14) 

15) 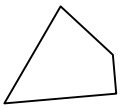

16) 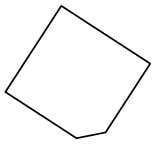

17) 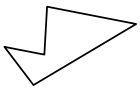

18) 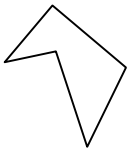

19) 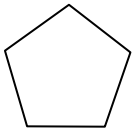

20)

Ответы

1. _____
2. _____
3. _____
4. _____
5. _____
6. _____
7. _____
8. _____
9. _____
10. _____
11. _____
12. _____
13. _____
14. _____
15. _____
16. _____
17. _____
18. _____
19. _____
20. _____

1-10	95	90	85	80	75	70	65	60	55	50
11-20	45	40	35	30	25	20	15	10	5	0

Определение четырехугольников Имя: Ключ к правильным ответам

Определите, изображен ли четырехугольник или нет. (да или нет)

1)

2) 

3) 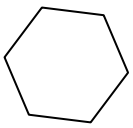

4) 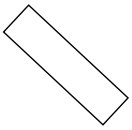

5) 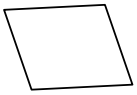

6) 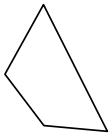

7) 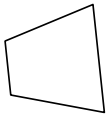

8) 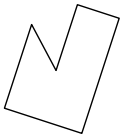

9)

10) 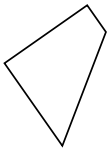

11)

12) 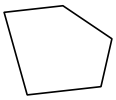

13) 

14) 

15) 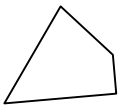

16) 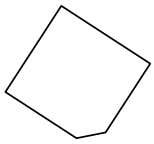

17) 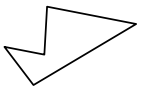

18) 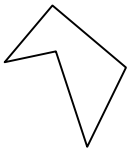

19) 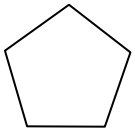

20)

Ответы

1. нет
2. нет
3. нет
4. да
5. да
6. да
7. да
8. нет
9. да
10. да
11. да
12. нет
13. да
14. нет
15. да
16. нет
17. нет
18. нет
19. нет
20. да

1-10	95	90	85	80	75	70	65	60	55	50
11-20	45	40	35	30	25	20	15	10	5	0