Определение симметрии Имя:

Определите, является ли данная линия линией симметрии.

об)

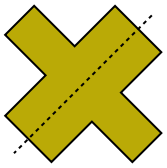

1)

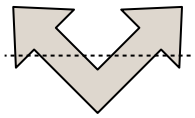

2)

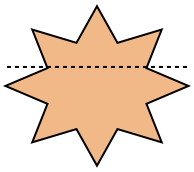

3)

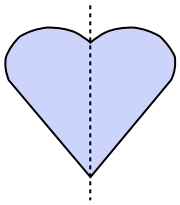

4)

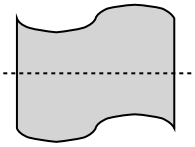

5)

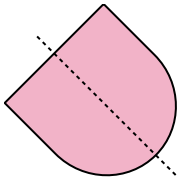

6)

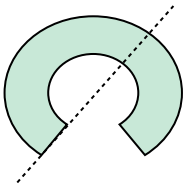

7)

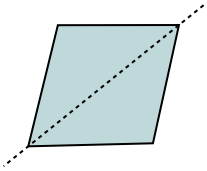

8)

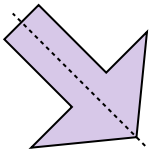

9)

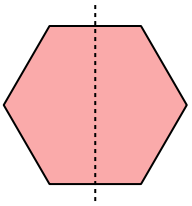

10)

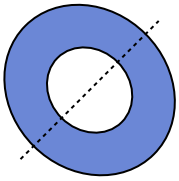

11)

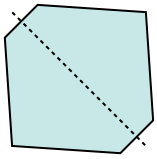

Ответы

об. **да**

1. _____

2. _____

3. _____

4. _____

5. _____

6. _____

7. _____

8. _____

9. _____

10. _____

11. _____

1-10	91	82	73	64	55	45	36	27	18	9
11	0									

Определите, является ли данная линия линией симметрии.

об)

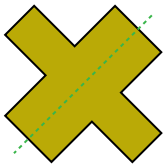

1)

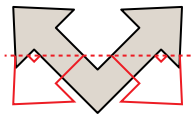

2)

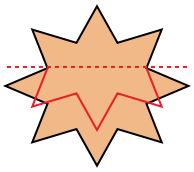

3)

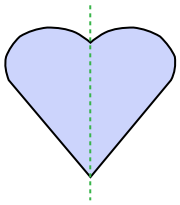

4)

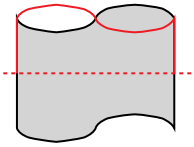

5)

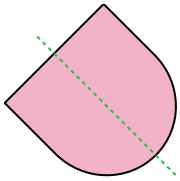

6)

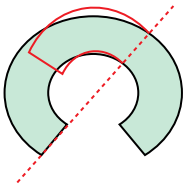

7)

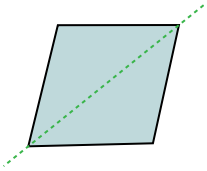

8)

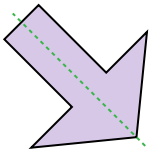

9)

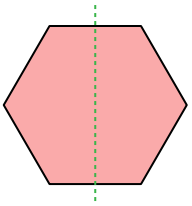

10)

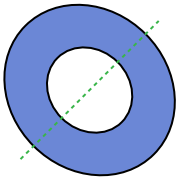

11)

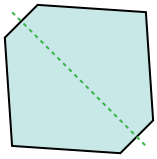

Ответы

об.	да
1.	no
2.	no
3.	да
4.	no
5.	да
6.	no
7.	да
8.	да
9.	да
10.	да
11.	да

1-10	91	82	73	64	55	45	36	27	18	9
11	0									