Изобразите часовые и минутные стрелки на часах так, чтобы они показывали определенное время.

1) 1:37

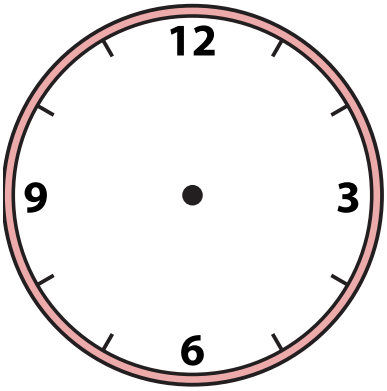

2) 8:21

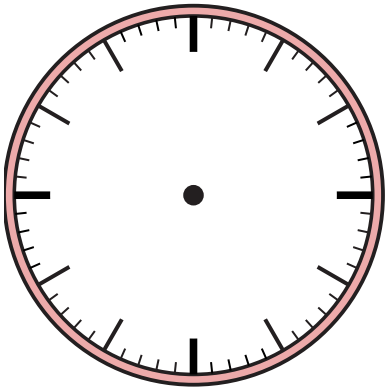

3) 1:12

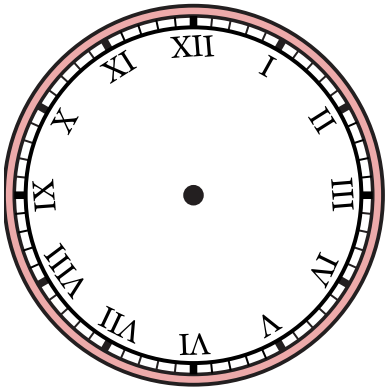

4) 12:42

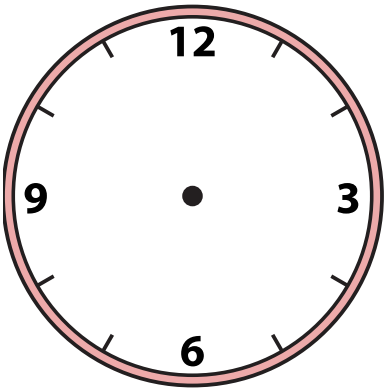

5) 4:16

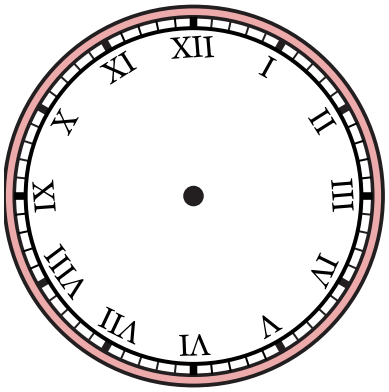

6) 10:18

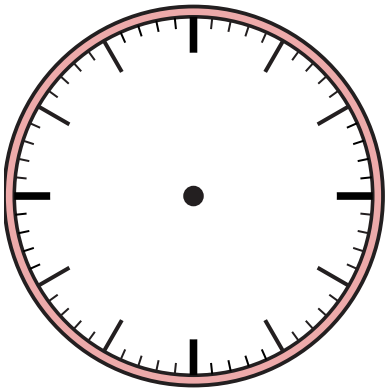

7) 6:57

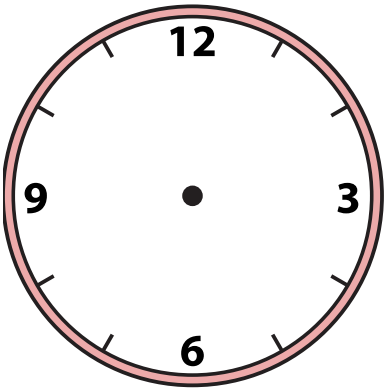

8) 2:58

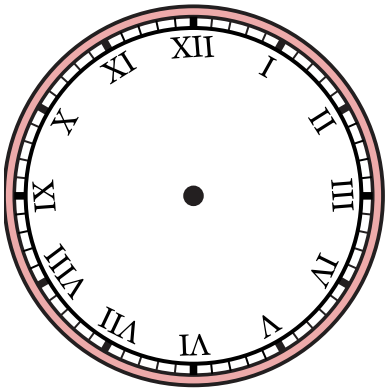

9) 4:29

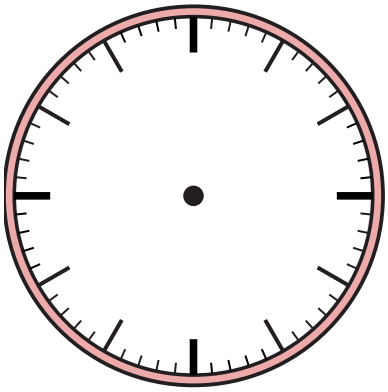

1-9	89	78	67	56	44	33	22	11	0

Изобразите часовые и минутные стрелки на часах так, чтобы они показывали определенное время.

1) 1:37



2) 8:21



3) 1:12



4) 12:42



5) 4:16

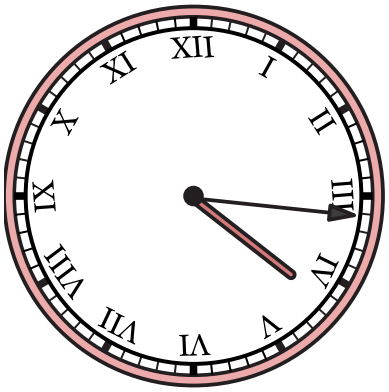

6) 10:18



7) 6:57



8) 2:58

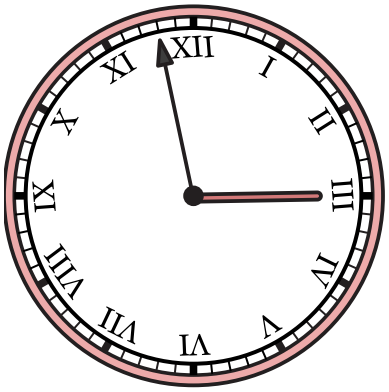

9) 4:29



1-9	89	78	67	56	44	33	22	11	0