Изобразите часовые и минутные стрелки на часах так, как это представлено.

1) 3:45



2) 3:10

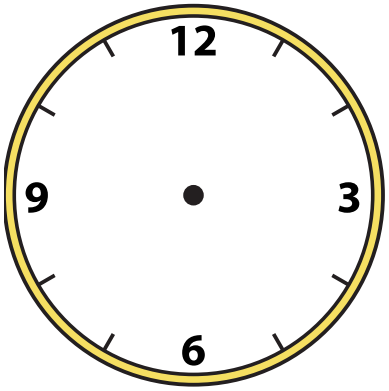

3) 4:40

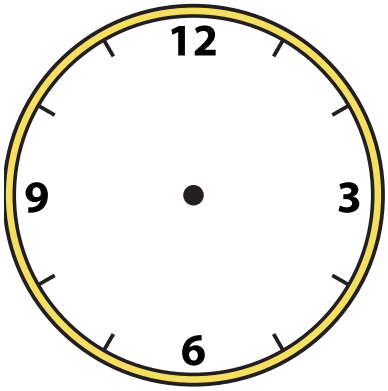

4) 8:30

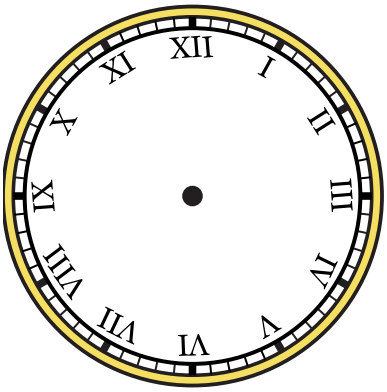

5) 1:45

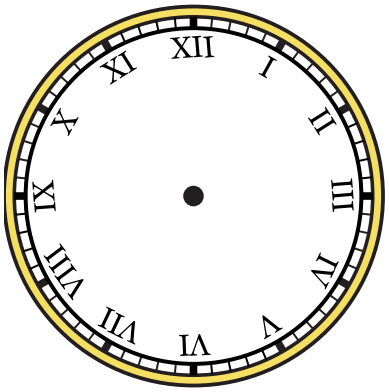

6) 9:20



7) 7:20

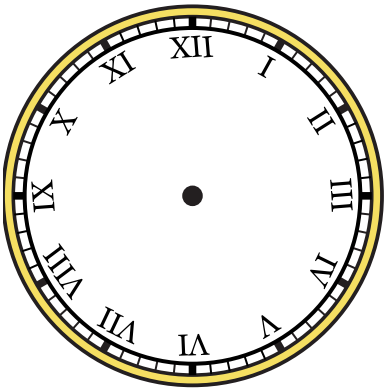

8) 4:55

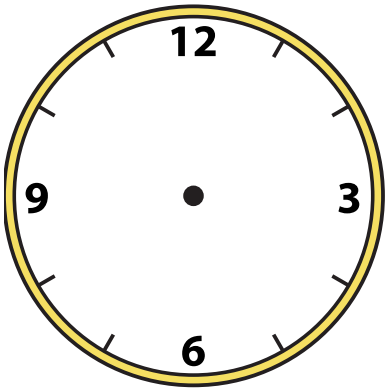

9) 5:10



1-9	89	78	67	56	44	33	22	11	0

Изобразите часовые и минутные стрелки на часах так, как это представлено.

1) 3:45

2) 3:10



3) 4:40

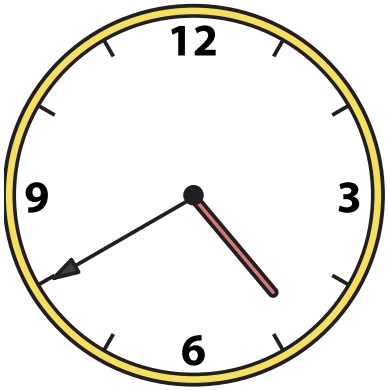

4) 8:30



5) 1:45



6) 9:20

7) 7:20

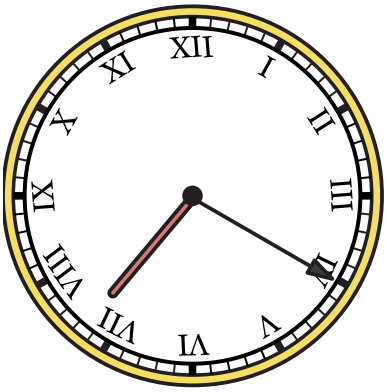

8) 4:55



9) 5:10

1-9	89	78	67	56	44	33	22	11	0