Подсчет фигур

Имя:

Подсчитайте количество фигур в каждом поле.

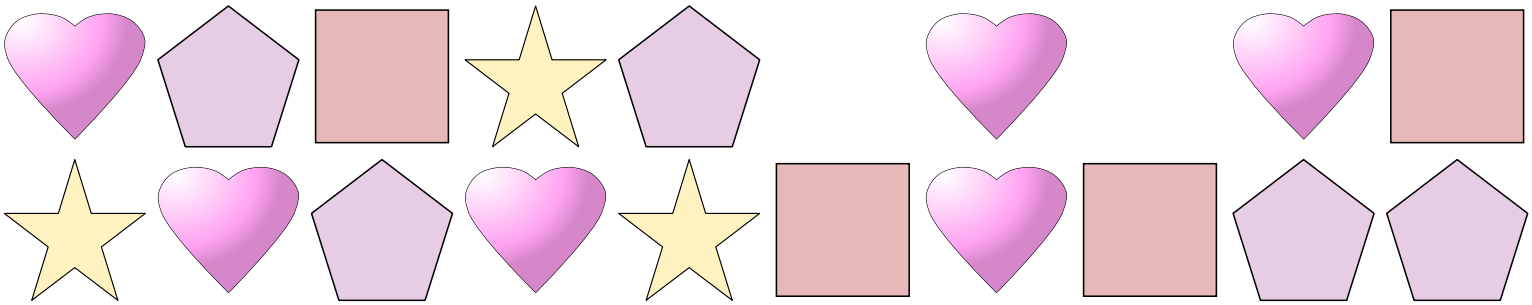

об) = 6

1) 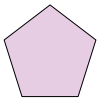 = _____

2) = _____

3) = _____



4) = _____

5)  = _____

6) = _____

7) = _____



8) = _____

9) = _____

10) = _____

11) = _____

Подсчет фигур

Имя: **Ключ к правильным ответам**

Подсчитайте количество фигур в каждом поле.

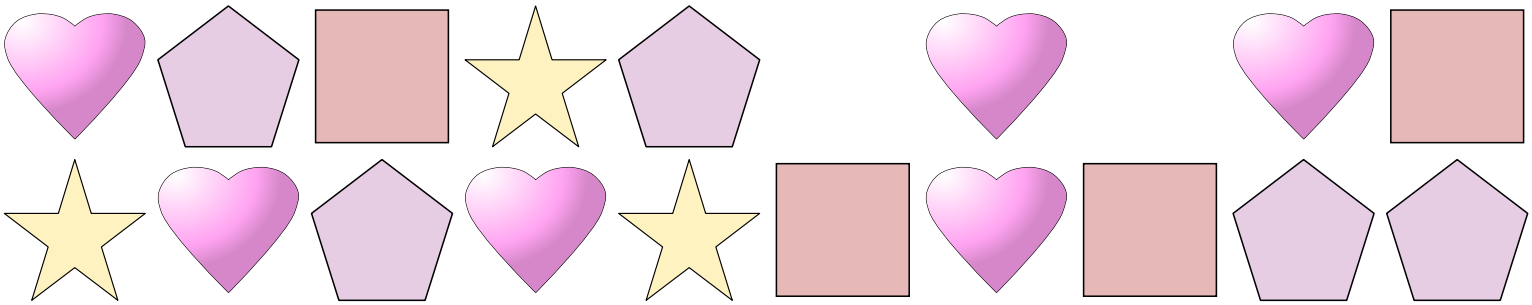

об) = 6

1) 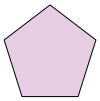 = 5

2) = 4

3) = 3



4) = 4

5)  = 3

6) = 4

7) = 5



8) = 4

9) = 3

10) = 6

11) = 4