Определение значения по блокам Имя:

Найдите значение, которое представлено блоками.

1) 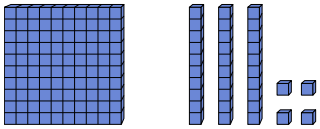

2) 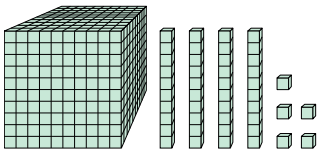

3) 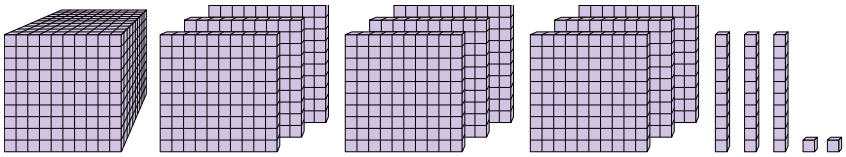

4) 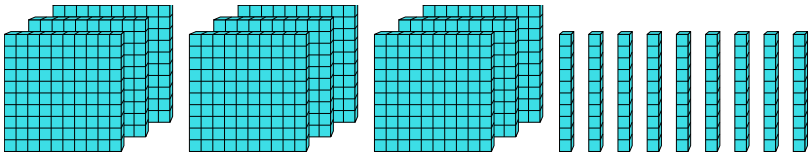

5) 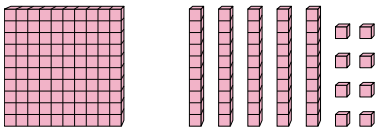

6) 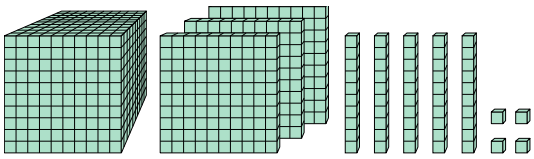

7) 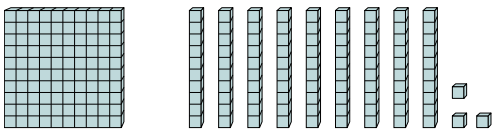

8) 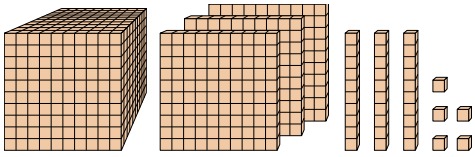

9) 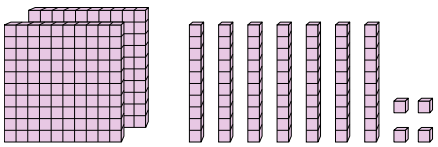

10) 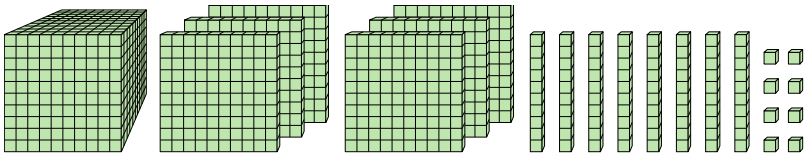

Ответы

1. _____
2. _____
3. _____
4. _____
5. _____
6. _____
7. _____
8. _____
9. _____
10. _____

1-10	90	80	70	60	50	40	30	20	10	0

Найдите значение, которое представлено блоками.

1) 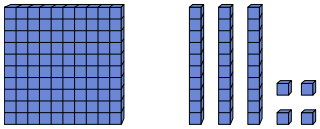

2) 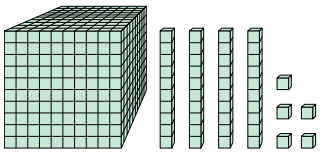

3) 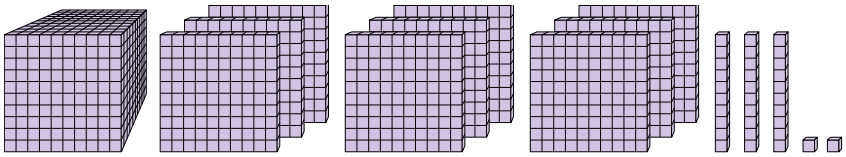

4) 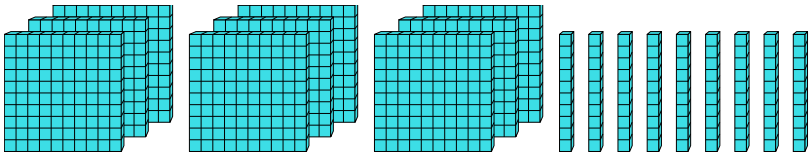

5) 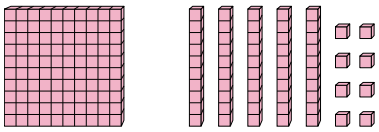

6) 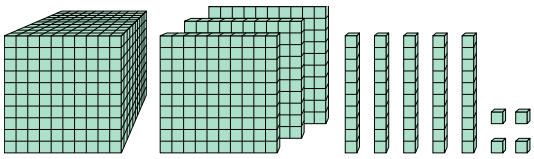

7) 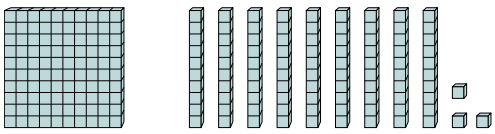

8) 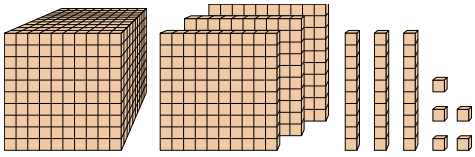

9) 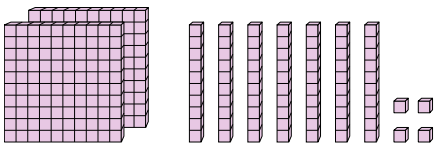

10) 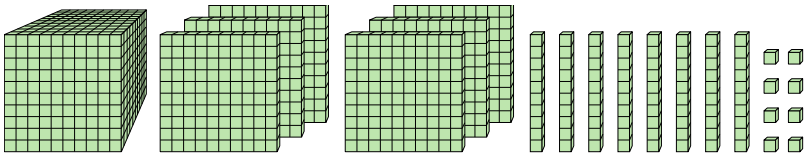

Ответы

1. 134
2. 1 045
3. 1 932
4. 990
5. 158
6. 1 354
7. 193
8. 1 335
9. 274
10. 1 688

1-10	90	80	70	60	50	40	30	20	10	0